Cambridge IGCSE

Cambridge International Examinations
Cambridge International General Certificate of Secondary Education

CANDIDATE NAME	
CENTRE NUMBER	
CANDIDATE NUMBER	

MATHEMATICS **0580/12**

Paper 1 (Core) **May/June 2015**

1 hour

Candidates answer on the Question Paper.

Additional Materials: Electronic calculator
Tracing paper (optional)
Geometrical instruments

READ THESE INSTRUCTIONS FIRST

Write your Centre number, candidate number and name on all the work you hand in.
Write in dark blue or black pen.
You may use an HB pencil for any diagrams or graphs.
Do not use staples, paper clips, glue or correction fluid.
DO **NOT** WRITE IN ANY BARCODES.

Answer **all** questions.
If working is needed for any question it must be shown below that question.
Electronic calculators should be used.
If the degree of accuracy is not specified in the question, and if the answer is not exact, give the answer to three significant figures. Give answers in degrees to one decimal place.
For π, use either your calculator value or 3.142.

At the end of the examination, fasten all your work securely together.
The number of marks is given in brackets [ ] at the end of each question or part question.
The total of the marks for this paper is 56.

The syllabus is approved for use in England, Wales and Northern Ireland as a Cambridge International Level 1/Level 2 Certificate.

This document consists of **11** printed pages and **1** blank page.

© UCLES 2015

CAMBRIDGE International Examinations

1 A doctor starts work at 20 40 and finishes work at 06 10 the next day.

View solution

How long is the doctor at work?
Give your answer in hours and minutes.

Answer ..... h ..... min [1]

---

2 Write 53 400 000 in standard form.

View solution

Answer ..... [1]

---

3 Write down the gradient of the line $y = -3x + 4$.

View solution

Answer ..... [1]

---

4 Simplify $5x^0$.

View solution

Answer ..... [1]

5

View solution

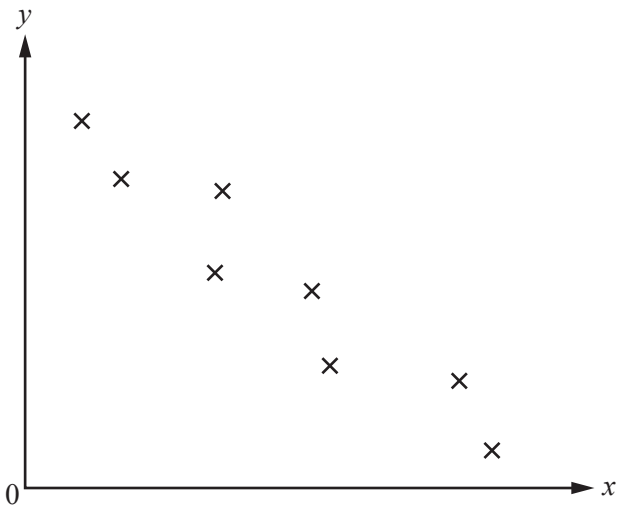

What type of correlation is shown on the scatter diagram?

Answer ..... [1]

© UCLES 2015

6 Write 64% as

(a) a decimal,

View solution

Answer(a) ..... [1]

(b) a fraction in its simplest form.

View solution

Answer(b) ..... [1]

---

7 Expand the brackets and simplify.

$$5(x - 3) - 3(x - 5)$$

View solution

Answer ..... [2]

---

8 Write the following in order of size, starting with the smallest.

View solution

3^{-2} 0.11 $\frac{2}{17}$ $\sqrt{0.011}$

Answer ..... < ..... < ..... < ..... [2]
smallest

---

9 A biased 4-sided dice is rolled.
The possible scores are 1, 2, 3 or 4.
The probability of rolling a 1, 3 or 4 is shown in the table.

View solution

Score	1	2	3	4
Probability	0.15		0.3	0.35

Complete the table. [2]

© UCLES 2015

10 Factorise completely.

$$3x^2y - 5xyz$$

View solution

Answer ..... [2]

11

View solution

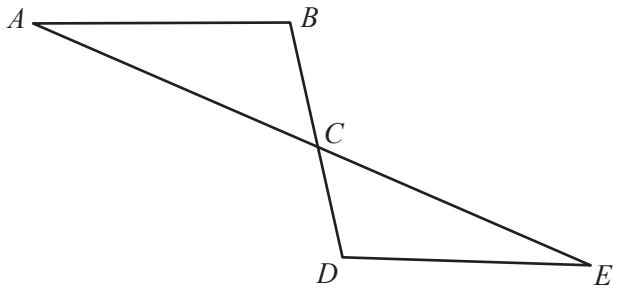

NOT TO SCALE

The diagram shows two straight lines, *AE* and *BD*, intersecting at *C*.
Angle *ABC* = angle *EDC*.
Triangles *ABC* and *EDC* are congruent.

Write down **two** properties of line segments *AB* and *DE*.

Answer AB and *DE* are .....

and ..... [2]

---

12 Without using a calculator, work out $\frac{4}{5} \div 2\frac{2}{3}$.

View solution

Write down all the steps of your working and give your answer as a fraction in its simplest form.

Answer ..... [3]

© UCLES 2015

13

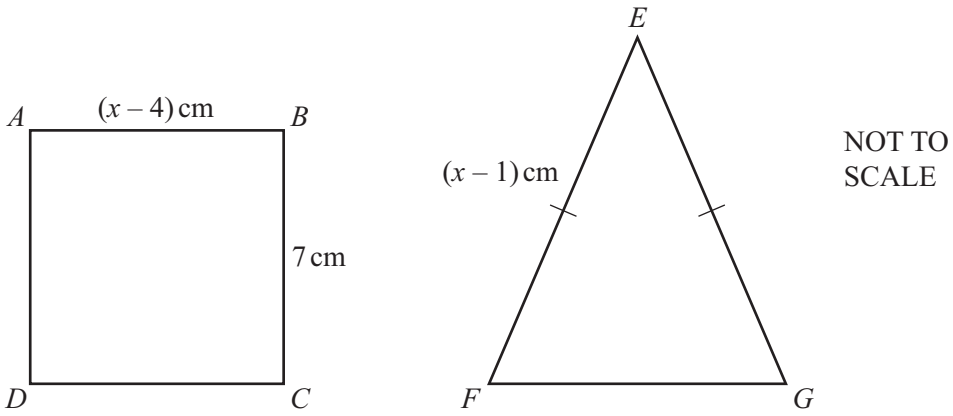

(a) *ABCD* is a square.

Find the value of x.

View solution

Answer(a) x = ... [1]

(b) Square *ABCD* and isosceles triangle *EFG* have the same perimeter.

Work out the length of *FG*.

View solution

Answer(b) FG = ... cm [2]

© UCLES 2015

14 Bernard invests \$480 at a rate of 4.5% per year compound interest.

View solution

Calculate the amount he receives at the end of 3 years.

Answer \$ ..... [3]

---

15 A random sample of 200 families was taken from the families in a city.
The number of children in each family was recorded.
The results are shown in the table below.

Number of children in a family	0	1	2	3	4	5 or more
Number of families	25	41	73	42	13	6

View solution

(a) Find the relative frequency of families with 2 children.

Answer(a) ..... [1]

View solution

(b) There are 5400 families in the city.

Find an estimate of the number of families with 2 children.

Answer(b) ..... [2]

© UCLES 2015

16

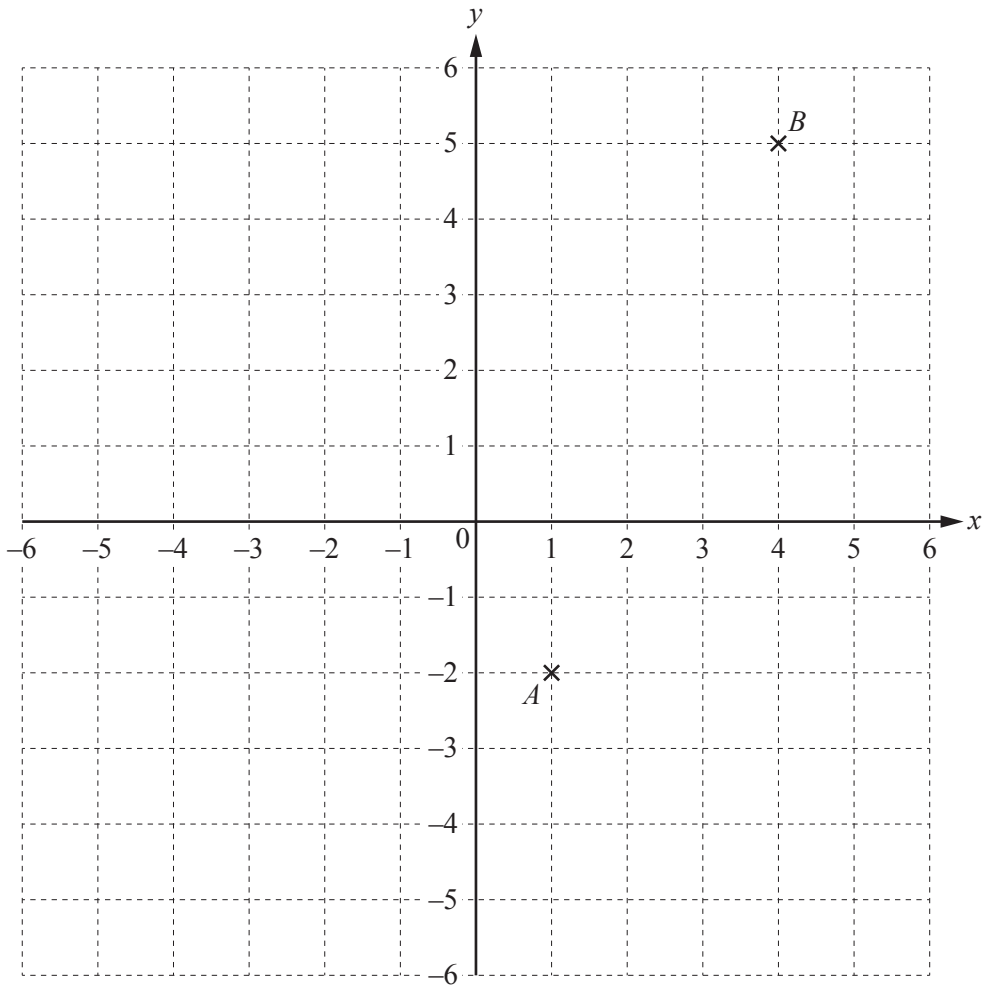

The diagram shows two points, A and B.

(a) Write down the column vector $\overrightarrow{AB}$.

View solution

Answer(a) $\overrightarrow{AB} = \begin{pmatrix} \quad \\ \quad \end{pmatrix}$ [1]

(b) $\overrightarrow{AC} = \begin{pmatrix} -5 \\ 2 \end{pmatrix}$

View solution

(i) On the grid, mark the point C. [1]

(ii) Write down the co-ordinates of C.

View solution

Answer(b)(ii) (..... , ...) [1]

© UCLES 2015

17

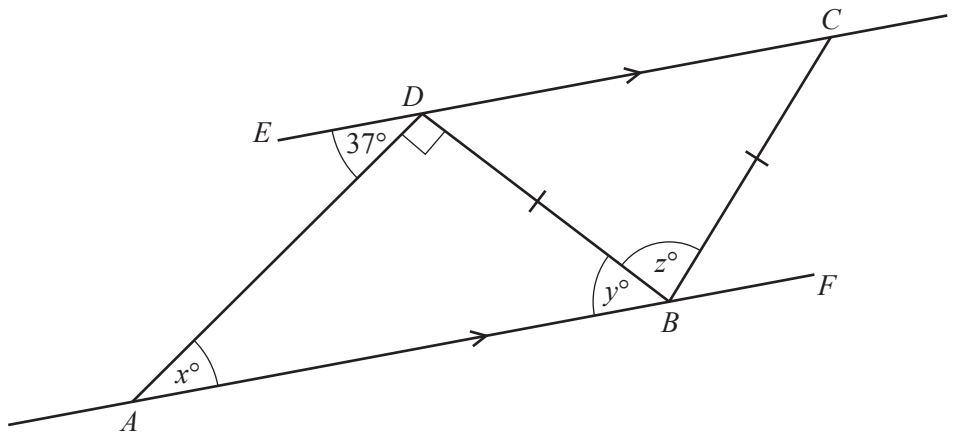

NOT TO SCALE

In the diagram, *ABF* is parallel to *EDC*.
Angle *EDA* = 37°, angle *ADB* is a right angle and *BC* = *BD*.

Find the value of

View solution

(a) *x*,

Answer(a) x = ... [1]

View solution

(b) *y*,

Answer(b) y = ... [1]

View solution

(c) *z*.

Answer(c) z = ... [2]

---

18 **(a)** Write down the next two terms in the following sequence.

View solution

73, 66, 59, 52, ... , ...

[2]

(b) Write down an expression for the *n*th term of the sequence in **part (a)**.

View solution

Answer(b) ..... [2]

19

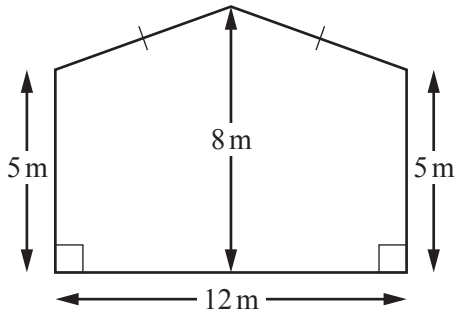

NOT TO SCALE

The diagram shows the front face of a barn.
The width of the barn is 12 m.
The height of the barn is 8 m.
The sides of the barn are both of height 5 m.

(a) Work out the area of the front face of the barn.

View solution

Answer(a) ..... m^2 [3]

(b) The length of the barn is 15 m.

Work out the volume of the barn.

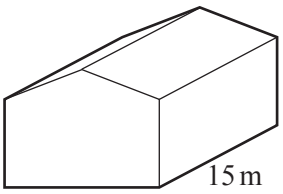

NOT TO SCALE

View solution

Answer(b) ..... m^3 [1]

20 (a)

View solution

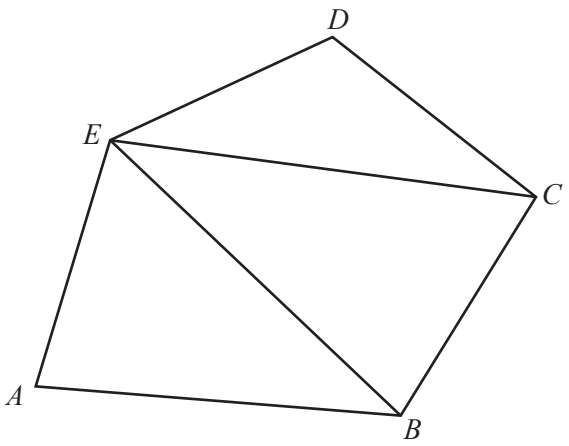

ABCDE is a pentagon.

Explain why the diagram shows that the sum of the interior angles of a pentagon is 540°.
Do not measure any angles.

Answer(a) ..... [1]

View solution

(b) Two interior angles of a pentagon are 79° and 53°.
The other three angles are in the ratio 1 : 3 : 4.

Calculate the size of each of these three angles.

Answer(b) ..... , ... , ... [4]

21 The average monthly temperatures (°C) in Silvas, Turkey, are shown in the table below.

Month	Jan	Feb	Mar	Apr	May	Jun	Jul	Aug	Sep	Oct	Nov	Dec
Temperature (°C)	–4	–3	2	8	13	17	19	20	16	11	8	–1

(a) Which month is the coldest?

View solution

Answer(a) ..... [1]

(b) Work out the difference between the temperature in November and the temperature in December.

View solution

Answer(b) ..... °C [1]

(c) Find the median temperature.

View solution

Answer(c) ..... °C [2]

(d) Calculate the mean temperature.
Give your answer correct to 2 significant figures.

View solution

Answer(d) ..... °C [3]

© UCLES 2015

BLANK PAGE

Permission to reproduce items where third-party owned material protected by copyright is included has been sought and cleared where possible. Every reasonable effort has been made by the publisher (UCLES) to trace copyright holders, but if any items requiring clearance have unwittingly been included, the publisher will be pleased to make amends at the earliest possible opportunity.

To avoid the issue of disclosure of answer-related information to candidates, all copyright acknowledgements are reproduced online in the Cambridge International Examinations Copyright Acknowledgements Booklet. This is produced for each series of examinations and is freely available to download at www.cie.org.uk after the live examination series.

Cambridge International Examinations is part of the Cambridge Assessment Group. Cambridge Assessment is the brand name of University of Cambridge Local Examinations Syndicate (UCLES), which is itself a department of the University of Cambridge.