Cambridge IGCSE

Cambridge International Examinations
Cambridge International General Certificate of Secondary Education

CANDIDATE NAME									
CENTRE NUMBER						CANDIDATE NUMBER				

MATHEMATICS **0580/43**

Paper 4 (Extended) **May/June 2015**

2 hours 30 minutes

Candidates answer on the Question Paper.

Additional Materials: Electronic calculator
Tracing paper (optional).
Geometrical instruments

READ THESE INSTRUCTIONS FIRST

Write your Centre number, candidate number and name on all the work you hand in.
Write in dark blue or black pen.
You may use an HB pencil for any diagrams or graphs.
Do not use staples, paper clips, glue or correction fluid.
DO **NOT** WRITE IN ANY BARCODES.

Answer **all** questions.
If working is needed for any question it must be shown below that question.
Electronic calculators should be used.
If the degree of accuracy is not specified in the question, and if the answer is not exact, give the answer to three significant figures. Give answers in degrees to one decimal place.
For π, use either your calculator value or 3.142.

At the end of the examination, fasten all your work securely together.
The number of marks is given in brackets [ ] at the end of each question or part question.
The total of the marks for this paper is 130.

The syllabus is approved for use in England, Wales and Northern Ireland as a Cambridge International Level 1/Level 2 Certificate.

This document consists of **16** printed pages.

© UCLES 2015

CAMBRIDGE International Examinations

1

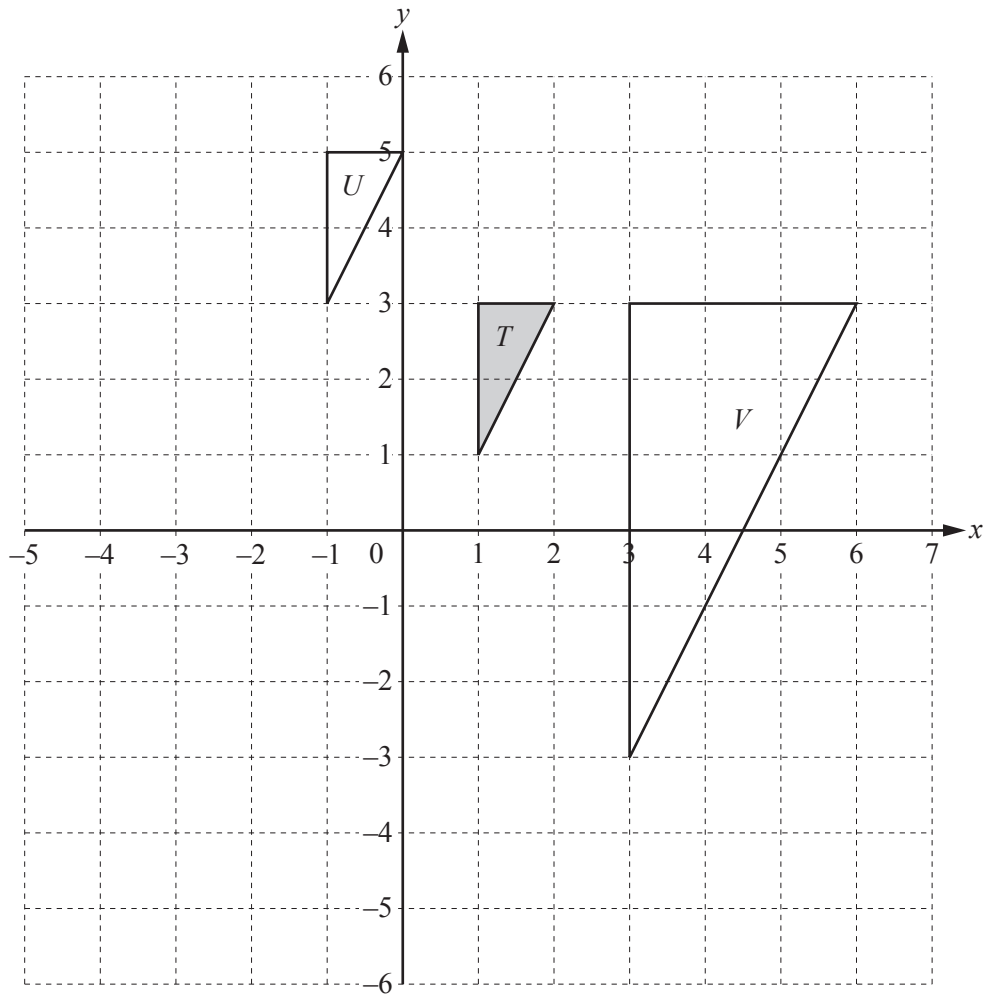

View solution

(a) On the grid, draw the image of

(i) triangle T after a reflection in the line $x = -1$, [2]

(ii) triangle T after a rotation through 180° about (0, 0). [2]

View solution

(b) Describe fully the **single** transformation that maps

(i) triangle T onto triangle U,

Answer(b)(i) .....

..... [2]

View solution

(ii) triangle T onto triangle V.

Answer(b)(ii) .....

..... [3]

2 **(a)** **(i)** Eduardo invests \$640 at a rate of 2% per year compound interest.

View solution

Show that, at the end of 6 years, Eduardo has \$721, correct to the nearest dollar.

Answer(a)(i)

[2]

(ii) Manuela also invests \$640.
At the end of 4 years, Manuela has \$721.

View solution

Find the yearly compound interest rate.

Answer(a)(ii) ..... % [4]

(b) Carlos buys a motor scooter for \$1200.
Each year the value of the scooter decreases by 10% of its value at the beginning of that year.

View solution

Find the value of the scooter after 3 years.

Answer(b) \$ ..... [2]

© UCLES 2015

3 $f(x) = \frac{8}{x^2} + \frac{x}{2}, \quad x \neq 0.$

View solution

(a) Complete the table of values for f(x).

x	–5	–4	–3	–2	–1.5		1.5	2	2.5	3	3.5	4	5
f(x)	–2.2	–1.5	–0.6		2.8		4.3		2.5	2.4	2.4		2.8

[3]

View solution

(b) On the grid, draw the graph of $y = f(x)$ for $-5 \leqslant x \leqslant -1.5$ and $1.5 \leqslant x \leqslant 5$.

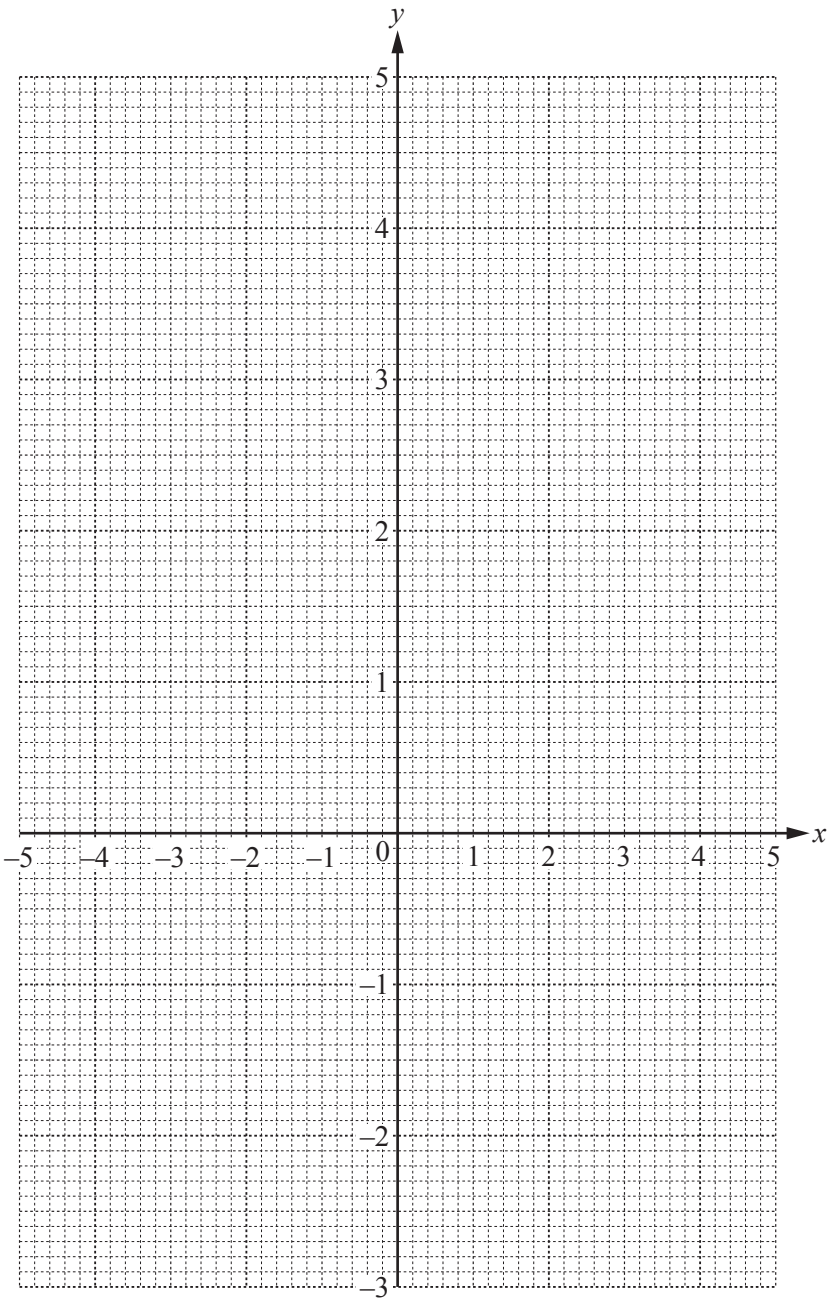

[5]

© UCLES 2015

(c) Solve f(x) = 0.

View solution

Answer(c) x = ... [1]

(d) By drawing a suitable line on the grid, solve the equation f(x) = 1 – x.

View solution

Answer(d) x = ... [3]

(e) By drawing a tangent at the point (–3, –0.6), estimate the gradient of the graph of y = f(x) when x = –3.

View solution

Answer(e) ..... [3]

© UCLES 2015

4 The table shows the times, t minutes, taken by 200 students to complete an IGCSE paper.

Time (t minutes)	$40 < t \leqslant 60$	$60 < t \leqslant 70$	$70 < t \leqslant 75$	$75 < t \leqslant 90$
Frequency	10	50	80	60

View solution

(a) By using mid-interval values, calculate an estimate of the mean time.

Answer(a) ..... min [3]

View solution

(b) On the grid, draw a histogram to show the information in the table.

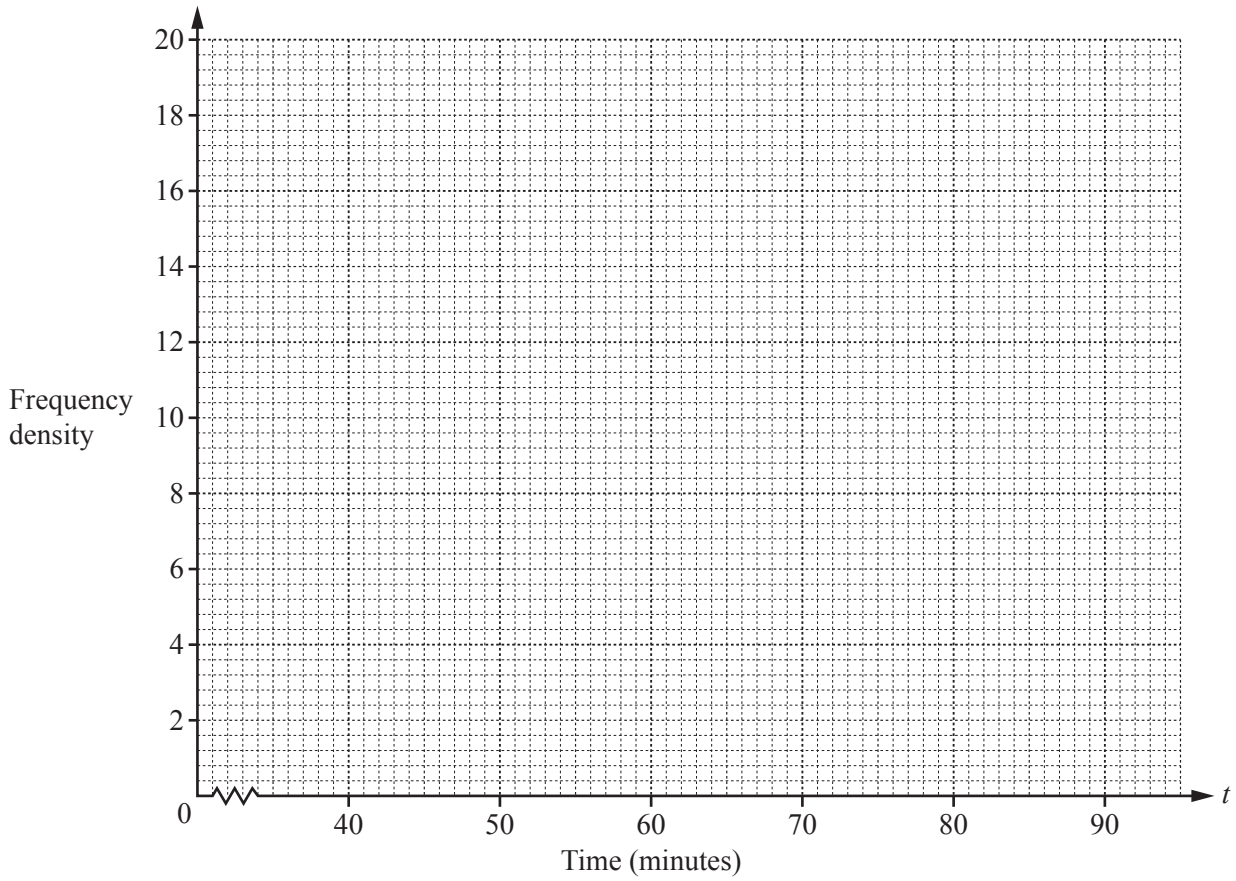

[4]

5



(a) One of these 7 cards is chosen at random.

View solution

Write down the probability that the card

(i) shows the letter *A*,

Answer(a)(i) ..... [1]

(ii) shows the letter *A* or *B*,

Answer(a)(ii) ..... [1]

(iii) does not show the letter *B*.

Answer(a)(iii) ..... [1]

(b) Two of the cards are chosen at random, without replacement.

View solution

Find the probability that

(i) both show the letter *A*,

Answer(b)(i) ..... [2]

(ii) the two letters are different.

View solution

Answer(b)(ii) ..... [3]

(c) Three of the cards are chosen at random, without replacement.

View solution

Find the probability that the cards do not show the letter *C*.

Answer(c) ..... [2]

© UCLES 2015

6 (a)

View solution

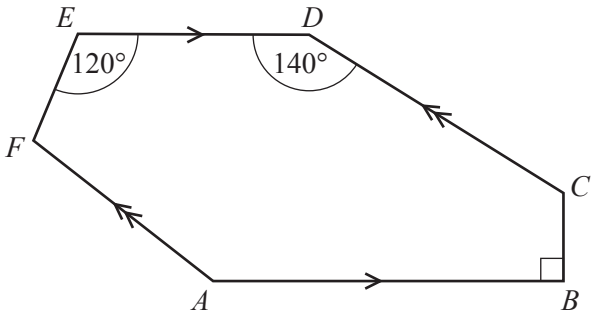

NOT TO SCALE

In the hexagon $ABCDEF$, AB is parallel to ED and AF is parallel to CD.
Angle $ABC = 90°$, angle $CDE = 140°$ and angle $DEF = 120°$.

Calculate angle EFA.

Answer(a) Angle EFA = ... [4]

(b)

View solution

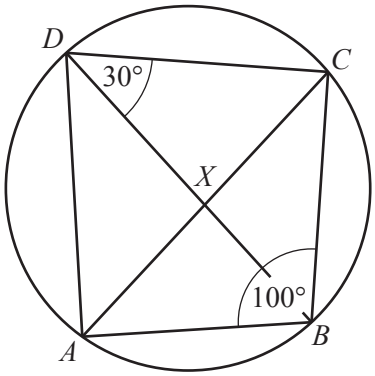

NOT TO SCALE

In the cyclic quadrilateral $ABCD$, angle $ABC = 100°$ and angle $BDC = 30°$.
The diagonals intersect at X.

(i) Calculate angle ACB.

Answer(b)(i) Angle ACB = ... [2]

(ii) Angle $BXC = 89°$.

Calculate angle CAD.

Answer(b)(ii) Angle CAD = ... [2]

(iii) Complete the statement.

Triangles AXD and BXC are ..... . [1]

© UCLES 2015

(c)

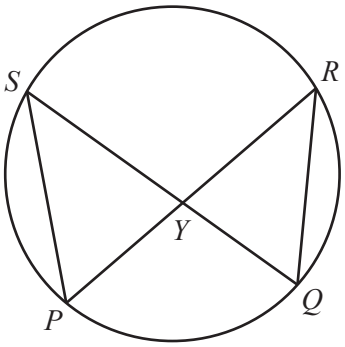

NOT TO SCALE

View solution

P, Q, R and S lie on a circle.
PR and QS intersect at Y.
$PS = 11$ cm, $QR = 10$ cm and the area of triangle $QRY = 23$ cm^2.

Calculate the area of triangle PYS.

Answer(c) ..... cm^2 [2]

(d) A regular polygon has n sides.
Each exterior angle is equal to $\frac{n}{10}$ degrees.

View solution

(i) Find the value of n.

Answer(d)(i) $n =$ ..... [3]

(ii) Find the size of an interior angle of this polygon.

View solution

Answer(d)(ii) ..... [2]

7 **(a)** The total surface area of a cone is given by the formula $A = \pi rl + \pi r^2$.

View solution

(i) Find A when $r = 6.2$ cm and $l = 10.8$ cm.

Answer(a)(i) ..... cm^2 [2]

(ii) Rearrange the formula to make l the subject.

View solution

Answer(a)(ii) $l =$ ..... [2]

(b) **(i)** Irina walks 10 km at 4 km/h and then a further 8 km at 5 km/h.

View solution

Calculate Irina's average speed for the whole journey.

Answer(b)(i) ..... km/h [3]

(ii) Dariella walks x km at 5 km/h and then runs $(x + 4)$ km at 10 km/h.
The average speed of this journey is 7 km/h.

View solution

Find the value of x.
Show all your working.

Answer(b)(ii) $x =$ ..... [5]

© UCLES 2015

(c) **(i)** Priyantha sells her model car for \$19.80 at a profit of 20%.

View solution

Calculate the original price of the model car.

Answer(c)(i) \$..... [3]

(ii) Dev sells his model car for \$$x$ at a profit of y%.

View solution

Find an expression, in terms of x and y, for the original price of this model car.
Write your answer as a single fraction.

Answer(c)(ii) \$..... [3]

© UCLES 2015

8 **(a)** A cylindrical tank contains 180 000 cm^3 of water.
The radius of the tank is 45 cm.

Calculate the height of water in the tank.

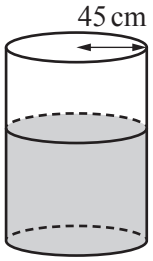

NOT TO SCALE

View solution

Answer(a) ..... cm [2]

(b)

View solution

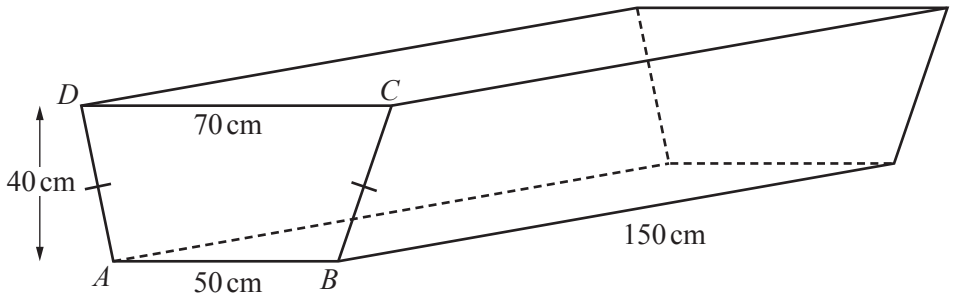

NOT TO SCALE

The diagram shows an empty tank in the shape of a horizontal prism of length 150 cm.
The cross section of the prism is an isosceles trapezium *ABCD*.
AB = 50 cm, *CD* = 70 cm and the vertical height of the trapezium is 40 cm.

(i) Calculate the volume of the tank.

Answer(b)(i) ..... cm^3 [3]

(ii) Write your answer to **part (b)(i)** in litres.

Answer(b)(ii) ..... litres [1]

(c) The 180 000 cm^3 of water flows from the tank in **part (a)** into the tank in **part (b)** at a rate of 15 cm^3/s.

Calculate the time this takes.
Give your answer in hours and minutes.

View solution

Answer(c) ..... h ..... min [3]

© UCLES 2015

(d)

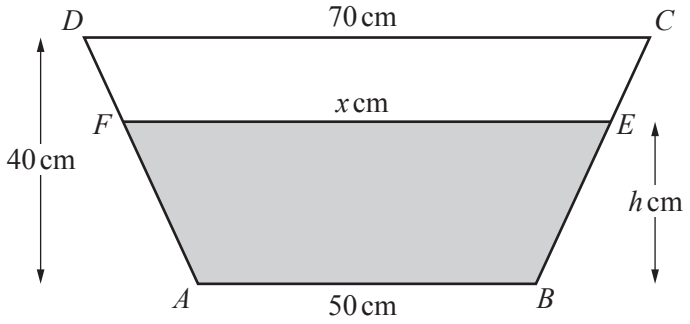

NOT TO SCALE

The 180 000 cm^3 of water reaches the level EF as shown above.
$EF = x$ cm and the height of the water is h cm.

(i) Using the properties of similar triangles, show that $h = 2(x - 50)$.

Answer(d)(i)

[2]

(ii) Using $h = 2(x - 50)$, show that the shaded area, in cm^2, is $x^2 - 2500$.

Answer(d)(ii)

[1]

(iii) Find the value of x.

Answer(d)(iii) x = ... [2]

(iv) Find the value of h.

Answer(d)(iv) h = ... [1]

© UCLES 2015

9 $\mathbf{P} = \begin{pmatrix} 2 & 3 \\ 1 & 4 \end{pmatrix}$ $\mathbf{Q} = \begin{pmatrix} 1 & 2 \\ 0 & 3 \end{pmatrix}$ $\mathbf{R} = \begin{pmatrix} 0 & u \\ 1 & v \end{pmatrix}$ $\mathbf{S} = \begin{pmatrix} w & 3 \\ 8 & 2 \end{pmatrix}$

(a) Work out **PQ**.

View solution

Answer(a) ( ) [2]

(b) Find $\mathbf{Q}^{-1}$.

View solution

Answer(b) ( ) [2]

(c) **PR** = **RP**

Find the value of u and the value of v.

View solution

Answer(c) u = ...

v = ... [3]

(d) The determinant of **S** is 0.

Find the value of w.

View solution

Answer(d) w = ... [2]

© UCLES 2015

10 $f(x) = 2x - 1$ $g(x) = x^2 + x$ $h(x) = \frac{2}{x}$, $x \neq 0$

(a) Find ff(3).

View solution

Answer(a) ..... [2]

(b) Find gf(x), giving your answer in its simplest form.

View solution

Answer(b) ..... [3]

(c) Find $f^{-1}(x)$.

View solution

Answer(c) $f^{-1}(x) =$ ..... [2]

(d) Find $h(x) + h(x + 2)$, giving your answer as a single fraction.

View solution

Answer(d) ..... [4]

Question 11 is printed on the next page.

© UCLES 2015

11 The first four terms of sequences A, B, C and D are shown in the table.

Sequence	1st term	2nd term	3rd term	4th term	5th term		nth term
A	$\frac{1}{3}$	$\frac{2}{4}$	$\frac{3}{5}$	$\frac{4}{6}$			
B	3	4	5	6			
C	–1	0	1	2			
D	–3	0	5	12			

(a) Complete the table.

View solution

[8]

(b) Which term in sequence A is equal to $\frac{36}{37}$?

View solution

Answer(b) ..... [2]

(c) Which term in sequence D is equal to 725?

View solution

Answer(c) ..... [2]

Permission to reproduce items where third-party owned material protected by copyright is included has been sought and cleared where possible. Every reasonable effort has been made by the publisher (UCLES) to trace copyright holders, but if any items requiring clearance have unwittingly been included, the publisher will be pleased to make amends at the earliest possible opportunity.

To avoid the issue of disclosure of answer-related information to candidates, all copyright acknowledgements are reproduced online in the Cambridge International Examinations Copyright Acknowledgements Booklet. This is produced for each series of examinations and is freely available to download at www.cie.org.uk after the live examination series.

Cambridge International Examinations is part of the Cambridge Assessment Group. Cambridge Assessment is the brand name of University of Cambridge Local Examinations Syndicate (UCLES), which is itself a department of the University of Cambridge.

© UCLES 2015