Cambridge IGCSE

Cambridge International Examinations
Cambridge International General Certificate of Secondary Education

CANDIDATE NAME									
CENTRE NUMBER						CANDIDATE NUMBER				

MATHEMATICS **0580/11**

Paper 1 (Core) **May/June 2016**

1 hour

Candidates answer on the Question Paper.

Additional Materials: Electronic calculator
Tracing paper (optional)
Geometrical instruments

READ THESE INSTRUCTIONS FIRST

Write your Centre number, candidate number and name on all the work you hand in.
Write in dark blue or black pen.
You may use an HB pencil for any diagrams or graphs.
Do not use staples, paper clips, glue or correction fluid.
DO **NOT** WRITE IN ANY BARCODES.

Answer **all** questions.
If working is needed for any question it must be shown below that question.
Electronic calculators should be used.
If the degree of accuracy is not specified in the question, and if the answer is not exact, give the answer to three significant figures. Give answers in degrees to one decimal place.
For π, use either your calculator value or 3.142.

At the end of the examination, fasten all your work securely together.
The number of marks is given in brackets [ ] at the end of each question or part question.
The total of the marks for this paper is 56.

The syllabus is approved for use in England, Wales and Northern Ireland as a Cambridge International Level 1/Level 2 Certificate.

© UCLES 2016

CAMBRIDGE International Examinations

1 A train leaves Zurich at 22 40 and arrives in Vienna at 07 32 the next day.

View solution

Work out the time taken.

..... h ..... min [1]

2 From a sample of 80 batteries, 3 are faulty.

View solution

Work out the percentage of faulty batteries.

..... % [1]

3 In a group of students the probability that a student is left-handed is 0.28.
A student is chosen at random from the group.

View solution

Find the probability that this student is not left-handed.

.....[1]

4 Write 1.27×10^{-3} as an ordinary number.

View solution

.....[1]

5 Change 60 000 metres to kilometres.

View solution

..... km [1]

© UCLES 2016

6 Calculate $(2.1 - 0.078)^{17}$, giving your answer correct to 4 significant figures.

View solution

..... [2]

7 Write down the mathematical name for

(a) an angle that is less than 90°,

View solution

..... [1]

(b) a five-sided polygon.

View solution

..... [1]

8 Work out.

(a) $\begin{pmatrix} -2 \\ -3 \end{pmatrix} + \begin{pmatrix} -4 \\ 7 \end{pmatrix}$

View solution

$\begin{pmatrix} \quad \\ \quad \end{pmatrix}$ [1]

(b) $5\begin{pmatrix} 2 \\ -8 \end{pmatrix}$

View solution

$\begin{pmatrix} \quad \\ \quad \end{pmatrix}$ [1]

9

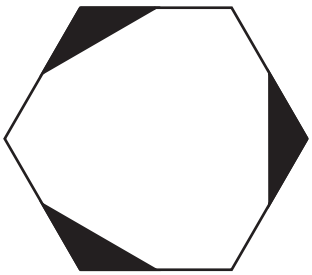

(a) Write down the order of rotational symmetry of the shape.

View solution

..... [1]

(b) Draw all the lines of symmetry on the shape. [1]

View solution

10 Omar changes 2000 Saudi Arabian riyals (SAR) into euros (€) when the exchange rate is €1 = 5.087 SAR.

Work out how much Omar receives, giving your answer correct to the nearest euro.

View solution

€ ..... [2]

11 Find the lowest common multiple (LCM) of 36 and 48.

View solution

..... [2]

12 $y = mx + c$

Find the value of y when $m = -2$, $x = -7$ and $c = -3$.

View solution

$y =$ ..... [2]

13 $y = \frac{qx}{p}$

Write x in terms of p, q and y.

View solution

$x =$ ..... [2]

© UCLES 2016

14

View solution

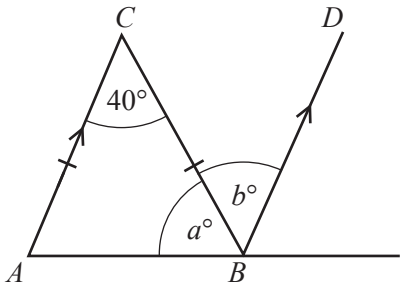

NOT TO SCALE

Triangle ABC is isosceles and AC is parallel to BD.

Find the value of a and the value of b.

a = ...

b = ... [2]

15 Triangle ABC and triangle DEF are similar.

View solution

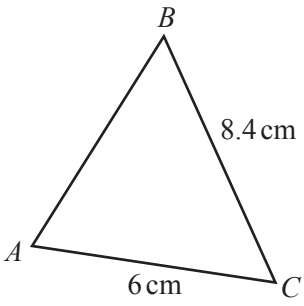

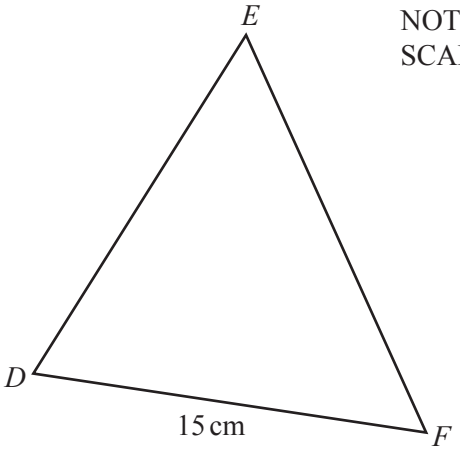

NOT TO SCALE

Calculate the length of EF.

EF = ... cm [2]

16 **Without using a calculator**, work out $\frac{6}{7} \div 1\frac{2}{3}$.

View solution

Show all your working and give your answer as a fraction in its lowest terms.

..... [3]

17 Find the next term in each of these sequences.

(a) 3, 7, 11, 15, …

View solution

..... [1]

(b) 10, 7, 4, 1, …

View solution

..... [1]

(c) 1, 9, 25, 49, …

View solution

..... [1]

18 The scatter diagram shows the prices of houses for sale and their distances from the city centre.

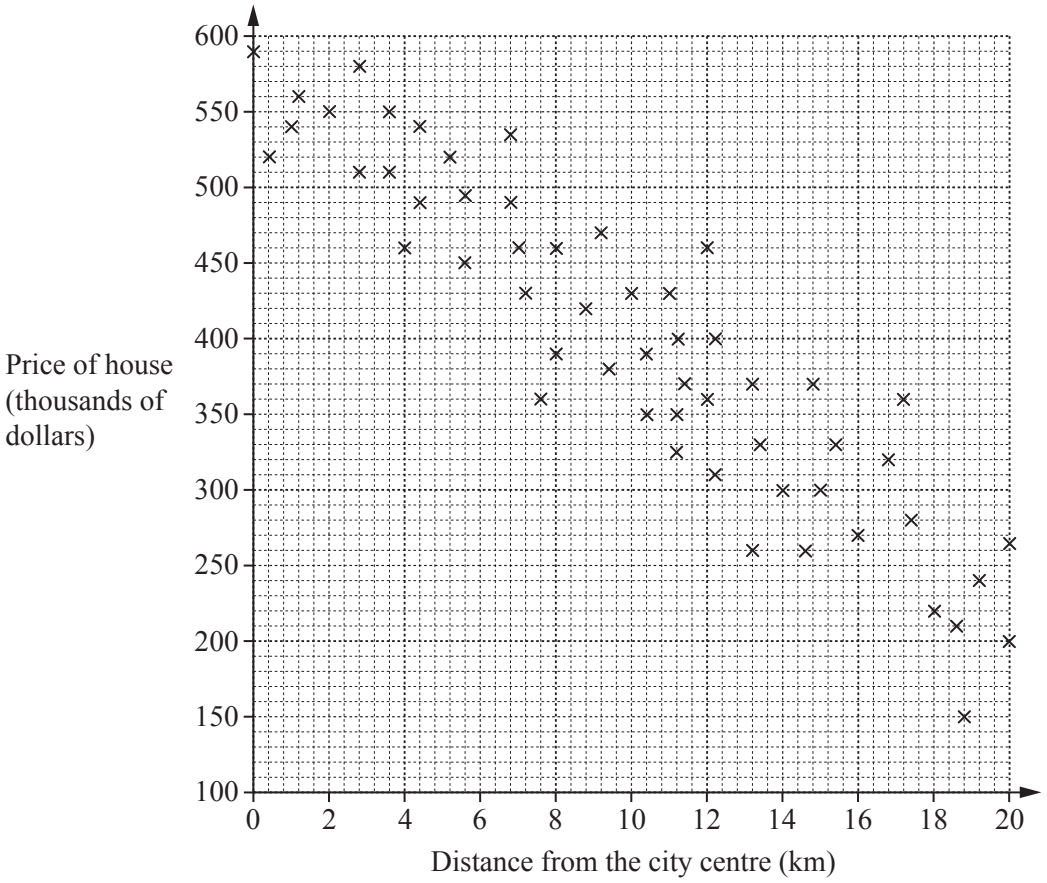

(a) What type of correlation is shown in this scatter diagram?

View solution

..... [1]

(b) Brad wants to live as close to the city centre as possible.
He has a maximum of $500 000 to spend on one of these houses.

View solution

How close to the city centre can he live?

..... km [1]

(c) **(i)** Draw a line of best fit on the scatter diagram. [1]

(ii) Estimate the price of a house that is 14 km from the city centre.

View solution

$..... [1]

© UCLES 2016

19 (a) Using a straight edge and compasses only, construct the bisector of angle *ABC*.

View solution

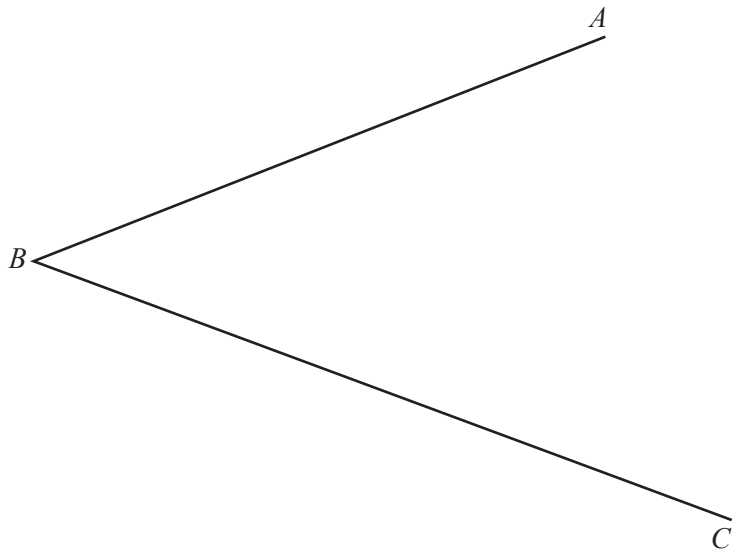

[2]

(b) Using a straight edge and compasses only, construct the perpendicular bisector of the line *DE*.

View solution



[2]

© UCLES 2016

20 Solve the simultaneous equations.
You must show all your working.

View solution

$$2x + 3y = 15$$
$$5x + 4y = 13$$

$x =$ .....

$y =$ ..... [4]

21 (a)

View solution

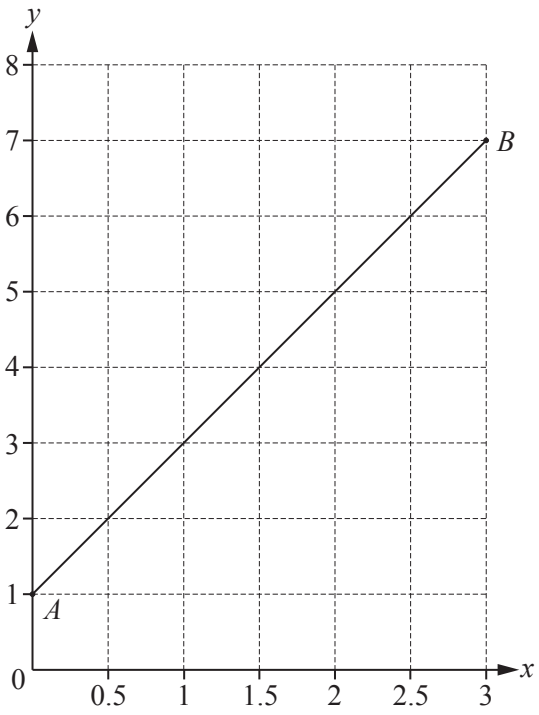

The line AB is drawn on the grid.

(i) Write down the co-ordinates of A.

(..... , ...) [1]

(ii) Work out the gradient of the line AB.

View solution

..... [2]

(iii) Write down the equation of the line AB in the form $y = mx + c$.

View solution

$y =$ ..... [2]

(b) Write down the equation of a straight line that is parallel to $y = 5x - 3$.

View solution

..... [1]

© UCLES 2016

22 (a)

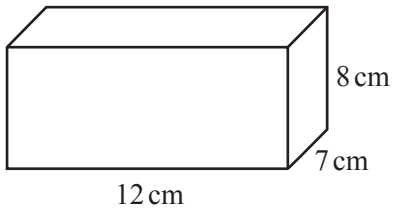

NOT TO SCALE

View solution

Calculate the volume of this cuboid.

..... cm^3 [2]

(b) Another cuboid has width 6 cm, height 9 cm and volume 675 cm^3.

View solution

Calculate the length of this cuboid.

..... cm [2]

(c) The diagram shows a right-angled triangular prism.

View solution

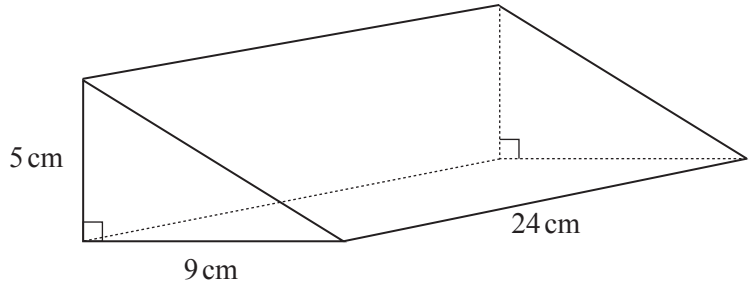

NOT TO SCALE

Calculate the volume of this prism.

..... cm^3 [3]

BLANK PAGE

Permission to reproduce items where third-party owned material protected by copyright is included has been sought and cleared where possible. Every reasonable effort has been made by the publisher (UCLES) to trace copyright holders, but if any items requiring clearance have unwittingly been included, the publisher will be pleased to make amends at the earliest possible opportunity.

To avoid the issue of disclosure of answer-related information to candidates, all copyright acknowledgements are reproduced online in the Cambridge International Examinations Copyright Acknowledgements Booklet. This is produced for each series of examinations and is freely available to download at www.cie.org.uk after the live examination series.

Cambridge International Examinations is part of the Cambridge Assessment Group. Cambridge Assessment is the brand name of University of Cambridge Local Examinations Syndicate (UCLES), which is itself a department of the University of Cambridge.