Cambridge IGCSE

Cambridge International Examinations
Cambridge International General Certificate of Secondary Education

CANDIDATE NAME									
CENTRE NUMBER						CANDIDATE NUMBER			

MATHEMATICS **0580/33**

Paper 3 (Core) **May/June 2016**

2 hours

Candidates answer on the Question Paper.

Additional Materials: Electronic calculator
Tracing paper (optional)
Geometrical instruments

READ THESE INSTRUCTIONS FIRST

Write your Centre number, candidate number and name on all the work you hand in.
Write in dark blue or black pen.
You may use an HB pencil for any diagrams or graphs.
Do not use staples, paper clips, glue or correction fluid.
DO **NOT** WRITE IN ANY BARCODES.

Answer **all** questions.
If working is needed for any question it must be shown below that question.
Electronic calculators should be used.
If the degree of accuracy is not specified in the question, and if the answer is not exact, give the answer to three significant figures. Give answers in degrees to one decimal place.
For π, use either your calculator value or 3.142.

At the end of the examination, fasten all your work securely together.
The number of marks is given in brackets [ ] at the end of each question or part question.
The total of the marks for this paper is 104.

The syllabus is approved for use in England, Wales and Northern Ireland as a Cambridge International Level 1/Level 2 Certificate.

This document consists of **16** printed pages.

© UCLES 2016

CAMBRIDGE International Examinations

1 A wildlife park covers an area of 18 hectares.

View solution

(a) The 18 hectares is divided between enclosures, paths and buildings in the ratio

enclosures : paths : buildings = 11 : 14 : 5.

(i) Show that the area for enclosures is 6.6 hectares.

[1]

View solution

(ii) Calculate the area for paths and the area for buildings.

Paths ..... hectares

Buildings ..... hectares [2]

View solution

(b) Of the 6.6 hectares for enclosures, $\frac{7}{11}$ is for mammals and 30% is for reptiles.

Calculate the area for mammals and the area for reptiles.

Mammals ..... hectares

Reptiles ..... hectares [2]

© UCLES 2016

(c) The table shows the opening times of the wildlife park.

View solution

Days	Opening times
Monday to Friday	09 30 to 17 15
Saturday and Sunday	10 00 to 18 30

(i) Work out how long, in hours and minutes, the wildlife park is open on a Wednesday.

..... h ..... min [1]

(ii) Calculate the total time, in hours and minutes, that the wildlife park is open in one week.

View solution

..... h ..... min [2]

(d) This table shows the ticket prices for the wildlife park.

View solution

Adult	$11.00
Senior (age 65 and over)	$9.25
Child (age 4 to 16)	$7.50
Child (age 3 and under)	Free

Mr Lu visits the wildlife park with his wife, their children (aged 6 and 2) and his parents (both aged 67).

(i) Work out the total cost of the tickets for this visit.

$..... [2]

(ii) Mr Lu has a voucher for the wildlife park that reduces the total cost of the tickets to $42.

View solution

Calculate the percentage saving.

.....% [3]

© UCLES 2016

2 (a)

View solution

NOT TO SCALE

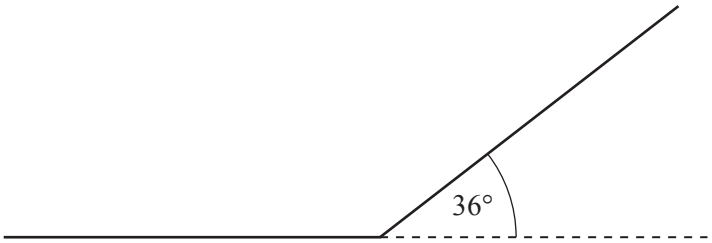

The diagram shows 2 sides of a regular polygon with exterior angle 36°.

For this regular polygon, work out

(i) the number of sides,

..... [2]

(ii) the interior angle,

View solution

..... [1]

(iii) the sum of the interior angles.

View solution

..... [1]

© UCLES 2016

(b) The diagram shows two shapes, A and B, on a 1 cm^2 grid.

View solution

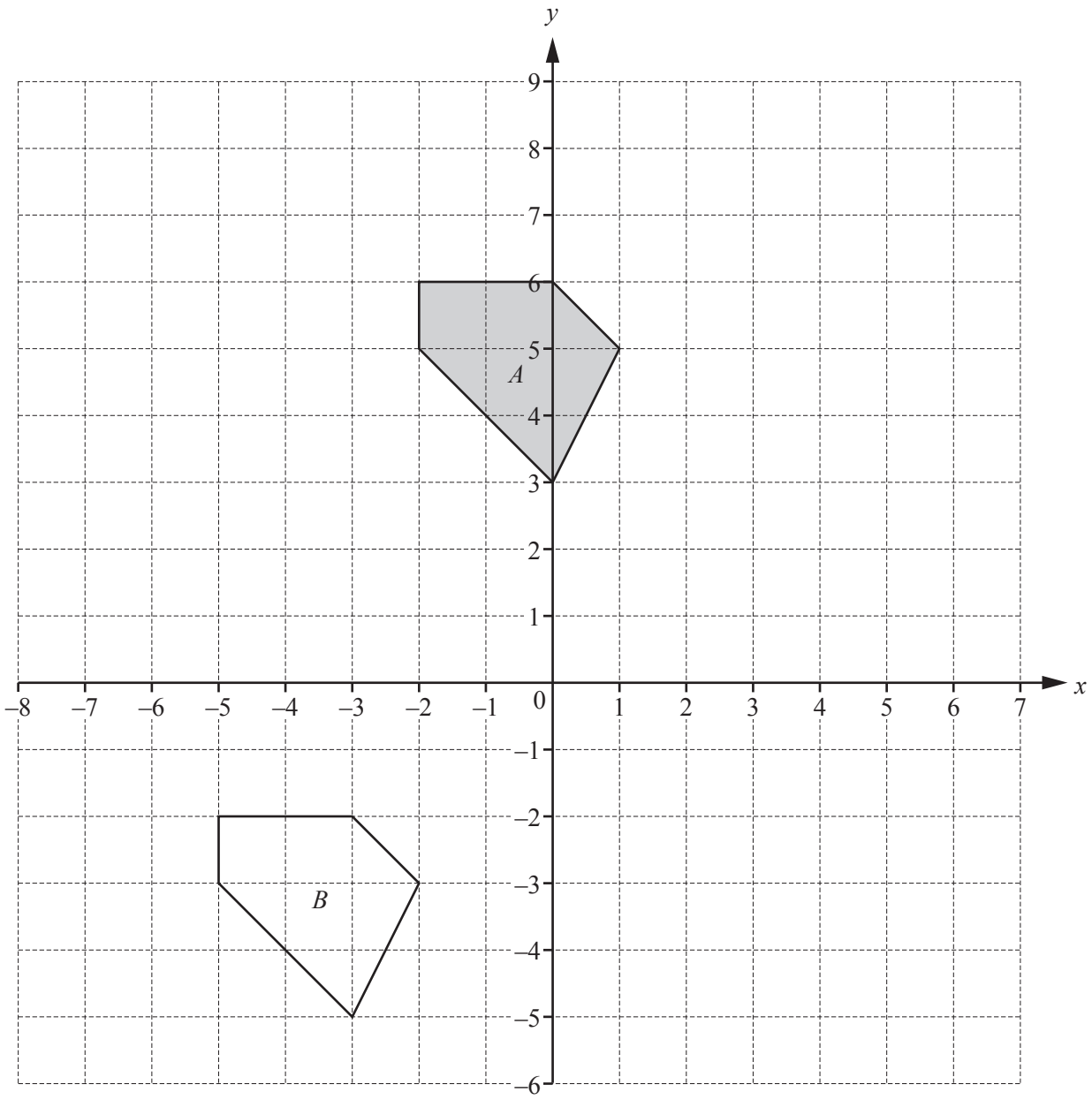

(i) Find the area of shape A.

..... cm^2 [1]

(ii) Describe fully the **single** transformation that maps shape A onto shape B.

View solution

.....

..... [2]

(iii) On the grid,

View solution

(a) draw the reflection of shape A in the line $x = 2$, [2]

(b) draw the enlargement of shape A with scale factor 2 and centre (1, 5). [2]

© UCLES 2016

3 The diagram shows a cylindrical flower vase with radius, r, and height, h.

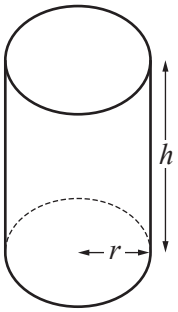

NOT TO SCALE

The volume, V, of the vase is $V = \pi r^2 h$.

The surface area, A, of the vase is $A = 2\pi rh + \pi r^2$.

(a) The vase has radius 4 cm and height 15 cm.

(i) Calculate the volume of the vase.
Write down the units of your answer.

View solution

.... [3]

(ii) Calculate the surface area of the vase.

View solution

..... cm^2 [2]

(b) Make h the subject of the formula $A = 2\pi rh + \pi r^2$.

View solution

h = ... [2]

(c) Factorise completely.

$$2\pi rh + \pi r^2$$

View solution

..... [2]

(d) Another cylindrical flower vase has radius 6 cm and height 22.5 cm.

View solution

(i) For this vase and the vase in **part (a)** the ratio of the radii is 4 : 6 and the ratio of the heights is 15 : 22.5 .

Write these ratios in their simplest form.

4 : 6 = ... : .....

15 : 22.5 = ... : ..... [2]

(ii) Write down a mathematical word to complete the statement.

View solution

The ratios show that the two vases are ..... [1]

© UCLES 2016

4 A garage sells second-hand cars.
The table shows the number of cars sold and the year they were made.

Year	2010	2011	2012	2013	2014	2015
Frequency	14	13	4	8	0	11

(a) Complete the bar chart to show this information.

View solution

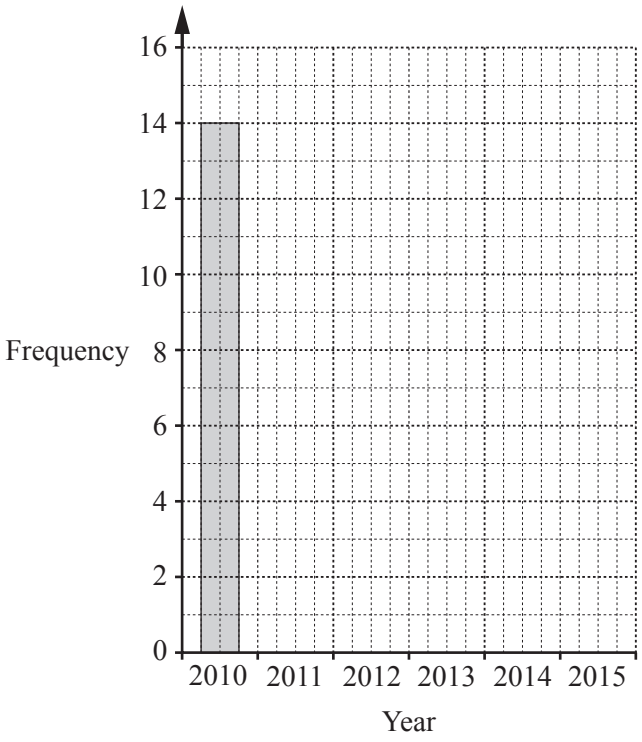

[2]

(b) For these cars, write down the modal year.

View solution

..... [1]

(c) The garage sold 6 cars last week.
The selling prices, in dollars, are listed below.

View solution

920 1070 3100 2240 2650 1840

(i) Work out the range.

$..... [1]

(ii) Work out the median.

View solution

$..... [2]

(iii) Calculate the mean.

View solution

$..... [2]

© UCLES 2016

5 **(a)** **(i)** Complete the table of values for $y = \frac{16}{x}$, $x \neq 0$.

View solution

x	−16	−8	−4	−2	−1	1	2	4	8	16
y	−1	−2		−8		16		4	2	

[2]

(ii) On the grid, draw the graph of $y = \frac{16}{x}$ for $-16 \leqslant x \leqslant -1$ and $1 \leqslant x \leqslant 16$.

View solution

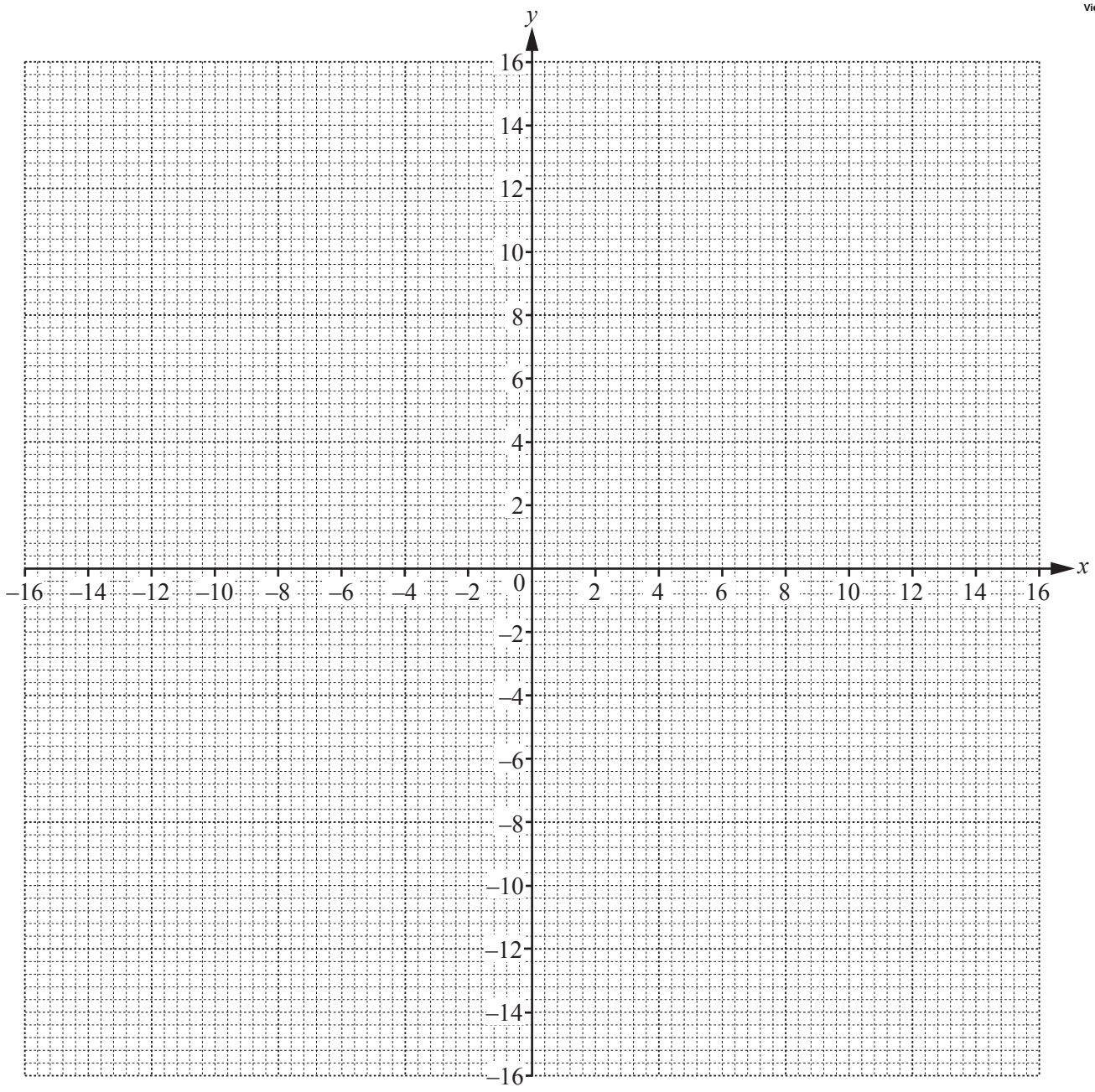

[4]

(b) Write down the order of rotational symmetry of your graph.

View solution

..... [1]

(c) One line of symmetry crosses the graph twice.

View solution

(i) Draw this line of symmetry on the grid. [1]

(ii) Write down the equation of this line of symmetry.

View solution

..... [1]

(d) By drawing a suitable line on the grid, solve the equation $\frac{16}{x} = 7$.

View solution

$x =$ ..... [2]

6 **(a)** For the integers from 40 to 70, write down

(i) a multiple of 19,

View solution

..... [1]

(ii) a common multiple of 6 and 8,

View solution

..... [1]

(iii) the square root of 2500,

View solution

..... [1]

(iv) a factor of 106,

View solution

..... [1]

(v) an odd number where the tens digit is double the units digit,

View solution

..... [1]

(vi) a number that is **both** a square number **and** a cube number,

View solution

..... [1]

(vii) a number that has exactly 3 factors,

View solution

..... [1]

(viii) three prime numbers.

View solution

..... , ... , ... [2]

© UCLES 2016

(b) Write 234 as a product of its prime factors.

View solution

..... [2]

(c) Write the answer to $3^4 \times 3^7$

View solution

(i) in the form 3^x,

..... [1]

(ii) as an integer,

View solution

..... [1]

(iii) in standard form.

View solution

..... [1]

(d) (i) Write 3^{-2} as a fraction.

View solution

..... [1]

(ii) Find the value of $3x^0$ when $x = 5$.

View solution

..... [1]

7 The scale drawing shows a park, *ABCDE*.
The scale is 1 centimetre represents 20 metres.

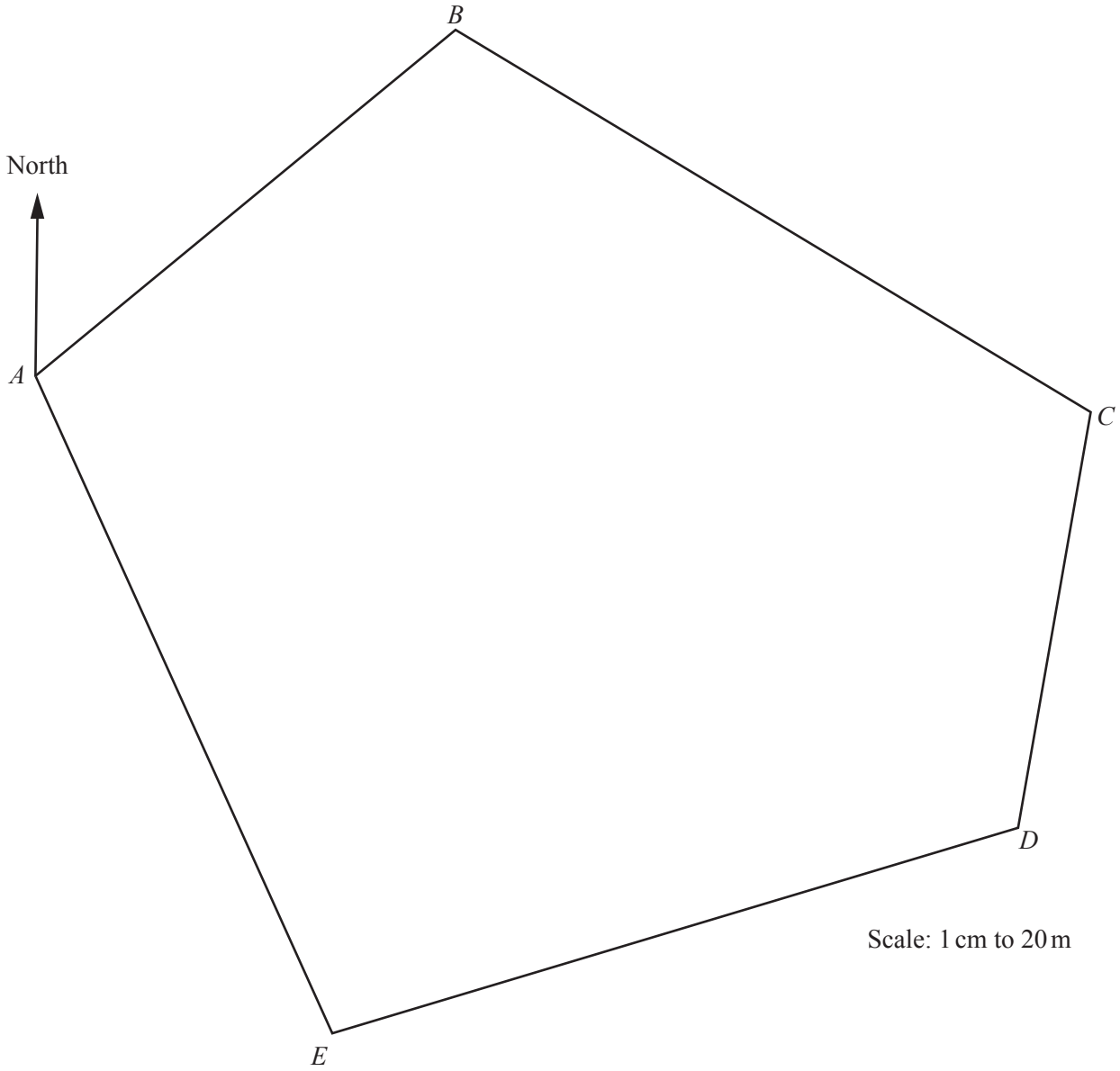

(a) Measure the bearing of *B* from *A*.

View solution

..... [1]

All constructions in the following parts must be completed using a straight edge and compasses only. All construction arcs must be clearly shown.

View solution

(b) A straight cycle path crosses the park from E to BC.
The path bisects angle AED.

(i) Construct the cycle path. [2]

View solution

(ii) Work out the actual length, in metres, of the cycle path.

..... m [2]

View solution

(iii) Alice cycles from E to BC along the path at a constant speed of 9 km/h.

(a) Show that 9 km/h is equivalent to 2.5 m/s.

[1]

(b) Find the time she takes to cycle from E to BC.
Give your answer in seconds.

.....s [2]

View solution

(c) A straight footpath, equidistant from D and E, crosses the park from DE to AB.

Construct the footpath. [2]

(d) **(i)** Construct the locus of points 150 metres from A and inside the park. [2]

(ii) A region for sports activities is less than 150 metres from A and closer to E than to D.

Shade this region. [1]

View solution

8

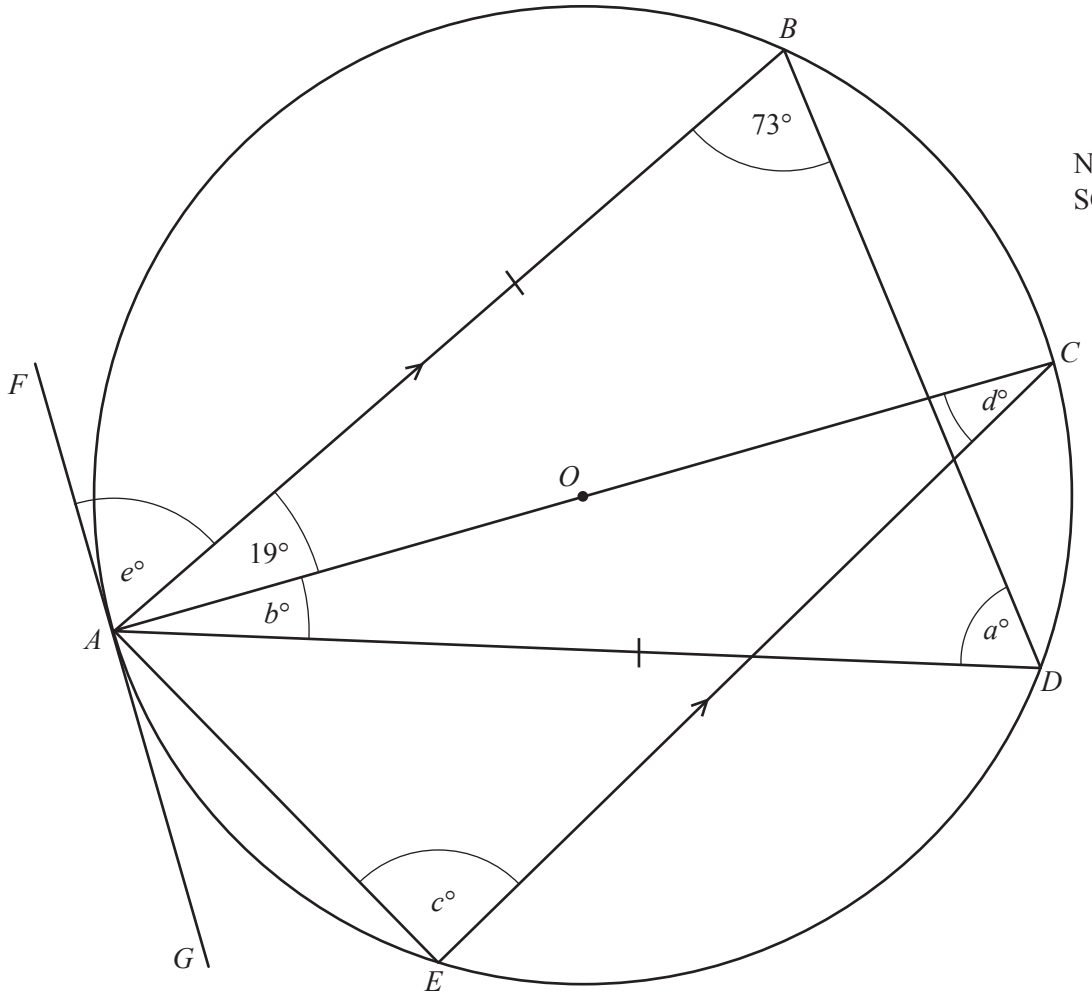

A, *B*, *C*, *D* and *E* are points on the circumference of a circle, centre *O*.
GAF is a tangent to the circle at *A*.
AB is parallel to *EC* and *AB* = *AD*.

(a) Write down the mathematical name of triangle *ABD*.

View solution

..... [1]

(b) Find the value of

(i) a,

View solution

$a =$ ..... [1]

(ii) b,

View solution

$b =$ ..... [1]

(iii) c,

View solution

$c =$ ..... [1]

(iv) d,

View solution

$d =$ ..... [1]

(v) e.

View solution

$e =$ ..... [2]

(c) The diameter, AC, of the circle is 13 cm.

View solution

Calculate the circumference of the circle.
Give your answer correct to 1 decimal place.

..... cm [3]

Question 9 is printed on the next page.

Permission to reproduce items where third-party owned material protected by copyright is included has been sought and cleared where possible. Every reasonable effort has been made by the publisher (UCLES) to trace copyright holders, but if any items requiring clearance have unwittingly been included, the publisher will be pleased to make amends at the earliest possible opportunity.

To avoid the issue of disclosure of answer-related information to candidates, all copyright acknowledgements are reproduced online in the Cambridge International Examinations Copyright Acknowledgements Booklet. This is produced for each series of examinations and is freely available to download at www.cie.org.uk after the live examination series.

Cambridge International Examinations is part of the Cambridge Assessment Group. Cambridge Assessment is the brand name of University of Cambridge Local Examinations Syndicate (UCLES), which is itself a department of the University of Cambridge.

© UCLES 2016

9 **(a)** A solid has 6 faces, 8 vertices and 12 edges.
All the edges have the same length.

View solution

Write down the mathematical name of this solid.

..... [1]

(b) Here is a sequence of diagrams made from identical square tiles.

View solution

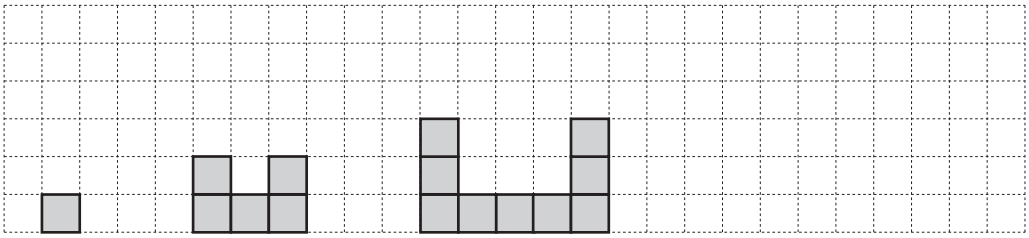

Diagram 1 Diagram 2 Diagram 3 Diagram 4

(i) On the grid, draw Diagram 4. [1]

(ii) Complete the table.

View solution

Diagram	1	2	3	4	5
Number of tiles	1	5	9		

[2]

(iii) Find an expression, in terms of n, for the number of tiles in Diagram n.

View solution

..... [2]

(iv) Find the number of tiles in Diagram 19.

View solution

..... [1]

(v) A box contains 98 of these tiles.

View solution

(a) Diagram x is made from as many tiles as possible from this box.

Find the value of x.

$x =$ ..... [2]

(b) When Diagram x is made, how many tiles are left in the box?

..... [1]

© UCLES 2016