Cambridge IGCSE

Cambridge International Examinations
Cambridge International General Certificate of Secondary Education

CANDIDATE NAME									
CENTRE NUMBER						CANDIDATE NUMBER				

MATHEMATICS **0580/32**

Paper 3 (Core) **May/June 2018**

2 hours

Candidates answer on the Question Paper.

Additional Materials: Electronic calculator
Tracing paper (optional)
Geometrical instruments

READ THESE INSTRUCTIONS FIRST

Write your Centre number, candidate number and name on all the work you hand in.
Write in dark blue or black pen.
You may use an HB pencil for any diagrams or graphs.
Do not use staples, paper clips, glue or correction fluid.
DO **NOT** WRITE IN ANY BARCODES.

Answer **all** questions.
If working is needed for any question it must be shown below that question.
Electronic calculators should be used.
If the degree of accuracy is not specified in the question, and if the answer is not exact, give the answer to three significant figures. Give answers in degrees to one decimal place.
For π, use either your calculator value or 3.142.

At the end of the examination, fasten all your work securely together.
The number of marks is given in brackets [ ] at the end of each question or part question.
The total of the marks for this paper is 104.

This document consists of **16** printed pages.

© UCLES 2018

CAMBRIDGE International Examinations

1 **(a)** Find the value of

(i) the square root of 19 044,

View solution

..... [1]

(ii) 2^7.

View solution

..... [1]

(b) n is an integer and $120 < n < 140$.

View solution

Find the value of n when it is

(i) a multiple of 45,

$n =$ ..... [1]

(ii) a square number,

View solution

$n =$ ..... [1]

(iii) a factor of 402,

View solution

$n =$ ..... [1]

(iv) a cube number.

View solution

$n =$ ..... [1]

(c) Work out the value of $\dfrac{21 - 15 \times 3}{18 \div 6 - 4}$.

View solution

..... [2]

(d) Estimate the value of $\dfrac{19.2 \times \sqrt{8.64}}{31.6 \div 6.32}$ by rounding each number in the calculation to 1 significant figure.

View solution

Show all your working by filling in the calculation below.

$$\frac{\ldots\ldots \times \sqrt{\ldots\ldots}}{\ldots\ldots \div \ldots\ldots} = \ldots\ldots$$ [2]

© UCLES 2018

2

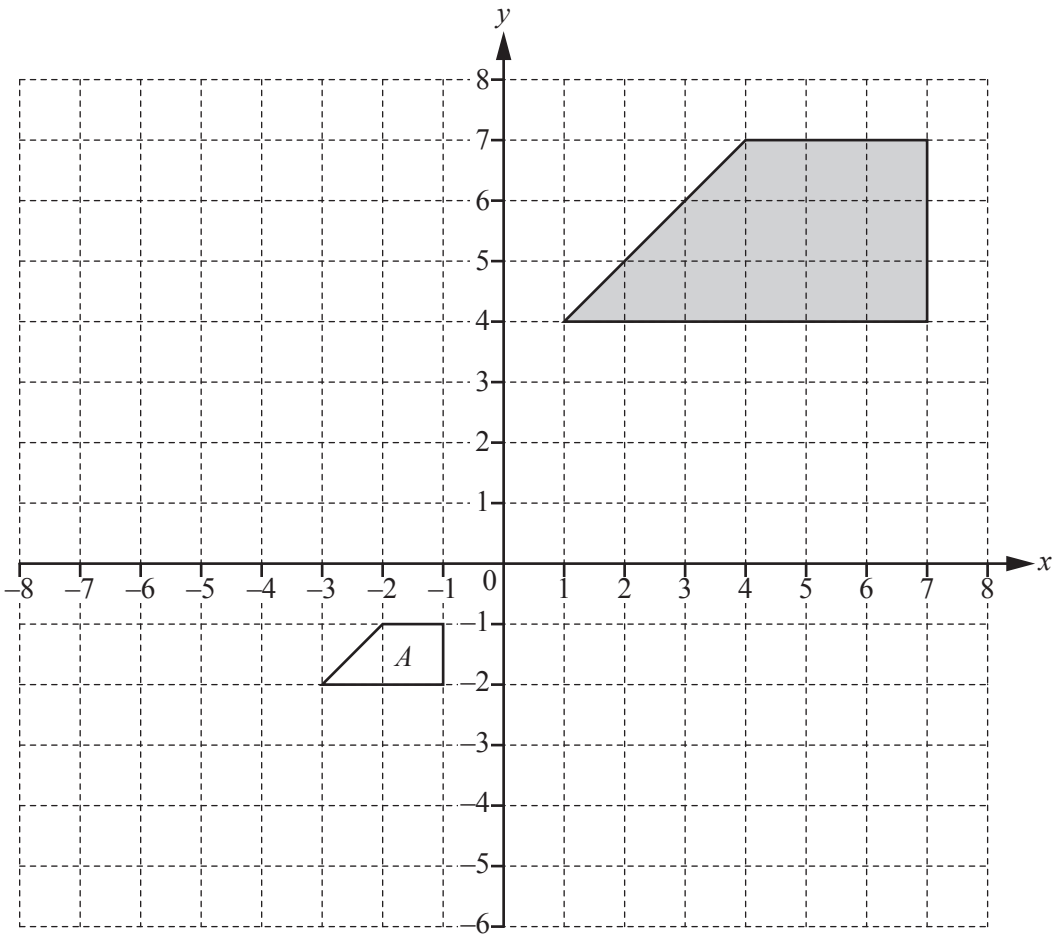

(a) Write down the mathematical name of the shaded quadrilateral shown on the grid.

View solution

..... [1]

(b) Describe fully the **single** transformation that maps the shaded quadrilateral onto quadrilateral *A*.

View solution

.....

..... [3]

(c) Complete this statement with a fraction in its simplest form.

View solution

The area of quadrilateral *A* is ..... of the area of the shaded quadrilateral. [3]

(d) On the grid, draw the image of

View solution

(i) shape *A* after a translation by the vector $\begin{pmatrix} -4 \\ 7 \end{pmatrix}$, [2]

(ii) shape *A* after a rotation of 180° about the origin, [2]

(iii) shape *A* after a reflection in the line $x = 2$. [2]

© UCLES 2018

3 A car company has three sales people, Anna, Mustapha and Joshua.

(a) During March, Anna sold 21 cars, Mustapha sold 12 cars and Joshua sold 15 cars.

View solution

Write down and simplify the ratio of the number of cars they sold during March.

Anna : Mustapha : Joshua = ... : ..... : ..... [2]

(b) Each month, they receive a bonus which is proportional to the number of cars they sell. The total bonus in March is \$1248.

View solution

(i) Show that Anna receives a bonus of \$546.

[1]

(ii) Calculate the bonuses received by Mustapha and Joshua.

View solution

Mustapha \$ .....

Joshua \$ ..... [2]

(c) The total bonus of \$1248 is $\frac{3}{7}$ of the total profit in March.

View solution

Calculate the total profit in March.

\$ ..... [2]

© UCLES 2018

(d) Ella wants to buy a car with a price of $13 500.
The company reduces this price by 16%.
Ella then pays a deposit of $500.

View solution

Show that the amount left for her to pay is $10 840.

[2]

(e) Ella borrows $10 840 from a bank.
She pays this back over 3 years at a rate of $340 per month.

View solution

(i) Show that the total amount she pays back during the 3 years is $12 240.

[1]

(ii) Calculate the percentage increase from $10 840 to $12 240.

View solution

.....% [3]

4 **(a)** Complete the table of values for $y = 5x - x^2$.

View solution

x	−1	0	1	2	3	4	5	6
y		0		6	6			−6

[2]

(b) On the grid, draw the graph of $y = 5x - x^2$ for $-1 \leqslant x \leqslant 6$.

View solution

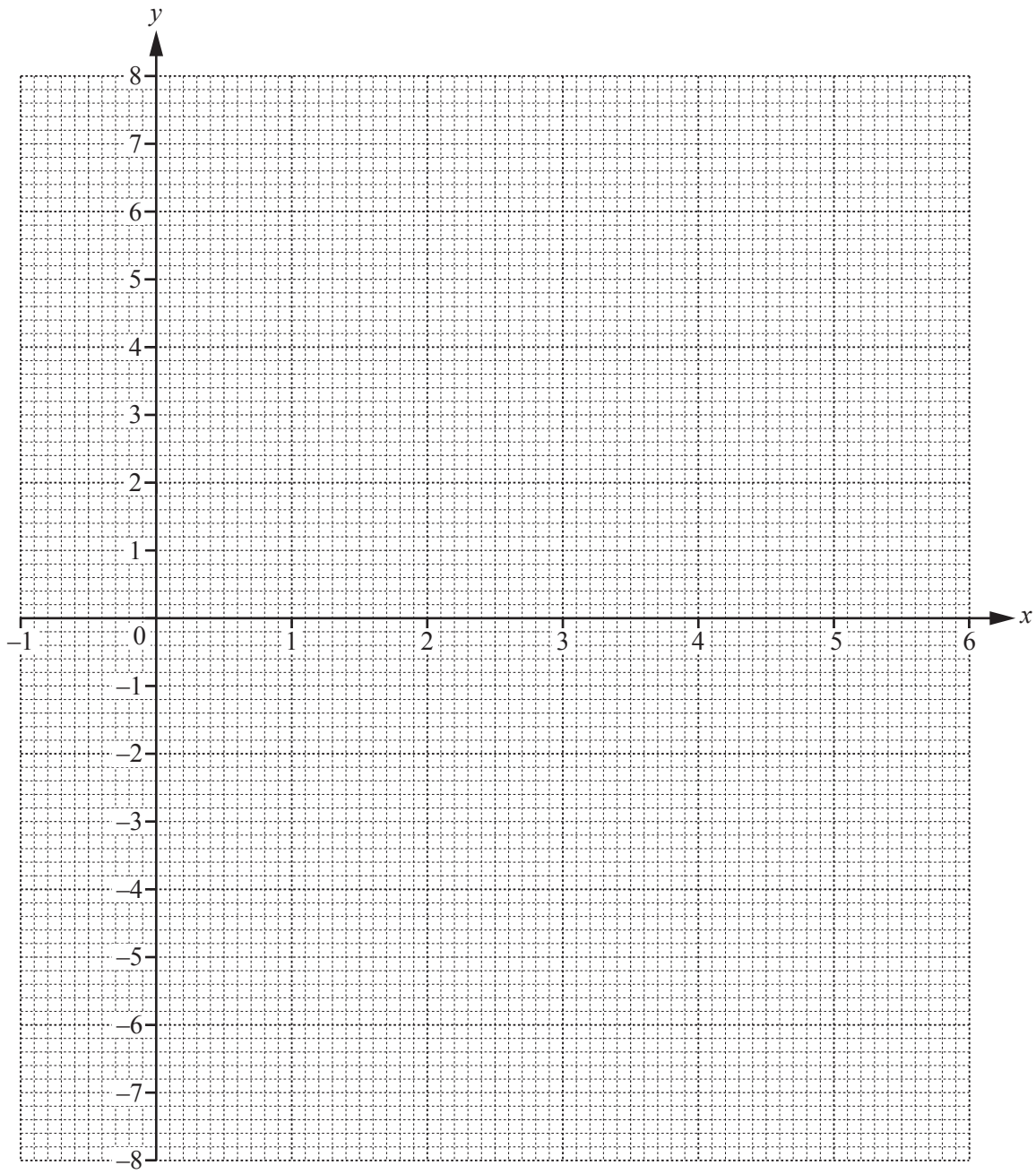

[4]

© UCLES 2018

(c) Write down the equation of the line of symmetry of the graph.

View solution

..... [1]

(d) **(i)** Complete the table of values for $y = 1.5x - 2$.

View solution

x	0	2	5
y			

[2]

(ii) On the grid, draw the graph of $y = 1.5x - 2$ for $-1 \leqslant x \leqslant 6$. [2]

(iii) Use your graphs to write down the solutions to the equation $1.5x - 2 = 5x - x^2$.

$x =$ ..... or $x =$ ..... [2]

© UCLES 2018

5 The scale drawing represents three sides, *AB*, *BC* and *CD*, of a wildlife park.
The scale is 1 centimetre represents 50 metres.

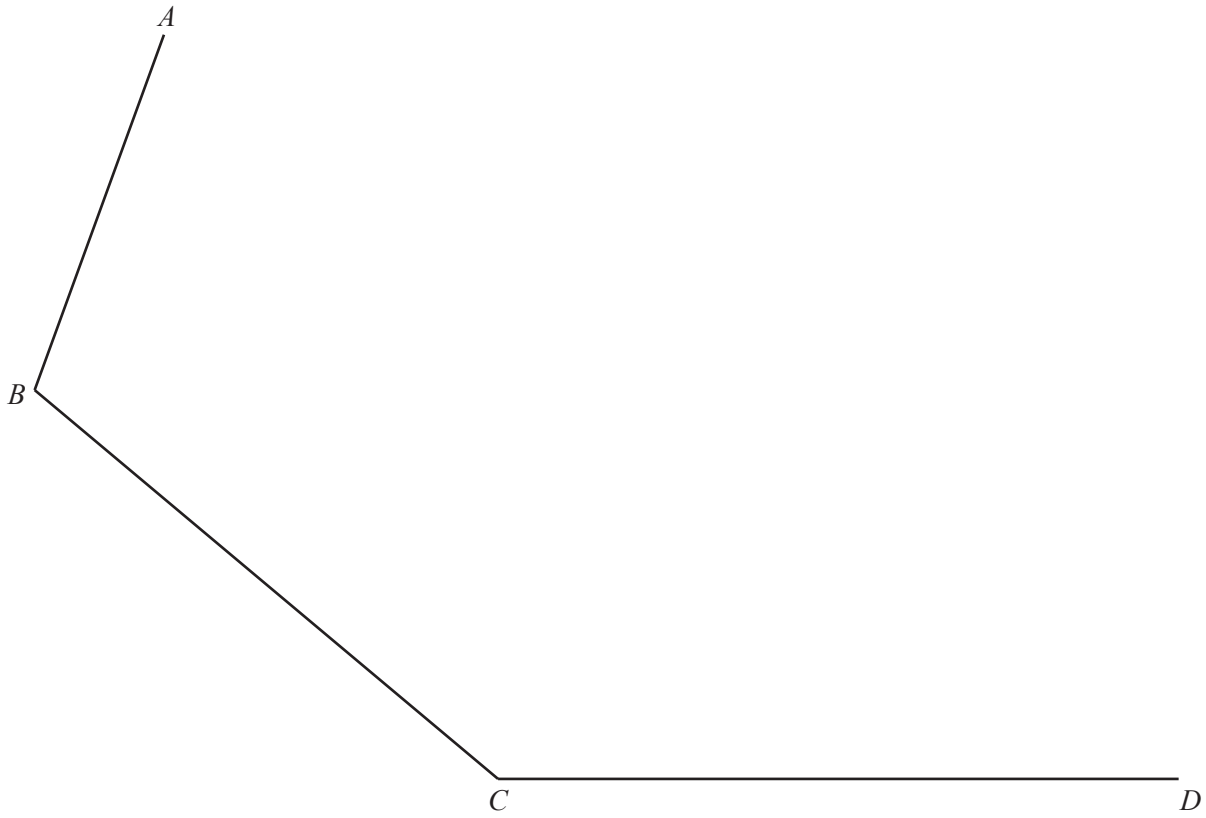

Scale: 1 cm to 50 m

(a) Find the actual distance AB in metres.

View solution

..... m [2]

(b) Point E is 550 metres from A and 600 metres from D.

View solution

Use a ruler and compasses only to find the point E and draw the lines AE and DE. [3]

(c) Two straight paths cross the wildlife park, $ABCDE$.

View solution

Using a straight edge and compasses only, construct

(i) the path that bisects angle ABC, [2]

(ii) the path that is equidistant from point C and point D. [2]

(d) The path from B crosses over a circular lake with radius 150 m.
The centre of the lake is on this path and is 350 m from B.

View solution

(i) On the scale drawing, construct the lake. [3]

(ii) Calculate the actual circumference of the lake in metres.

View solution

..... m [2]

© UCLES 2018

6 The 262 students at a college each study one of the languages shown in the table.

	French	German	Spanish	Italian	Japanese	Total
Boys	27		48	19		123
Girls		32	54		12	
Total		53		30		262

View solution

(a) Complete the table. [3]

View solution

(b) Find the probability that

(i) a girl, chosen at random, studies Spanish,

..... [1]

View solution

(ii) a boy, chosen at random, studies French or Italian,

..... [1]

View solution

(iii) a student, chosen at random, does not study German.

..... [1]

© UCLES 2018

(c) 72 students each study one of the sciences shown in the table.
The results are to be shown in a pie chart.

View solution

Science	Number of students	Pie chart sector angle
Biology	25	125°
Chemistry	16	
Physics	31	

(i) Complete the table. [2]

(ii) Complete the pie chart.

View solution

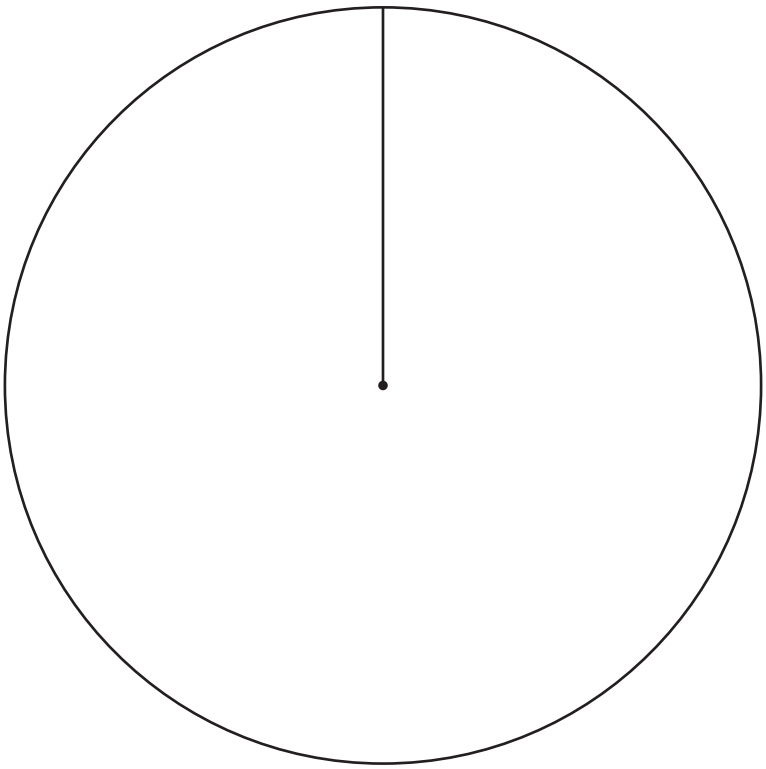

[2]

7 Louise leaves home at 09 55 and cycles the 5.6 km to the supermarket at a constant speed.
She takes 15 minutes to complete the journey.

(a) Write down the time she arrives at the supermarket.

View solution

..... [1]

(b) Calculate Louise's average speed from her home to the supermarket

View solution

(i) in kilometres per hour,

..... km/h [1]

(ii) in metres per second, giving your answer correct to 1 decimal place.

View solution

..... m/s [2]

(c) Louise stays at the supermarket for 23 minutes.

View solution

On the grid opposite, draw the travel graph of her journey from home and her stay at the supermarket.
[2]

(d) Louise's mother leaves home at 10 07 to meet Louise at the supermarket.
She cycles at a constant speed of 28 km/h.

View solution

(i) Work out how long she takes for the 5.6 km journey.
Give your answer in minutes.

..... min [2]

(ii) On the grid, show her mother's journey. [1]

(e) They cycle home together at a constant speed and arrive at 10 54.

View solution

(i) On the grid, show their journey home. [1]

(ii) Calculate, in km/h, their constant speed on the journey home.

View solution

..... km/h [2]

© UCLES 2018

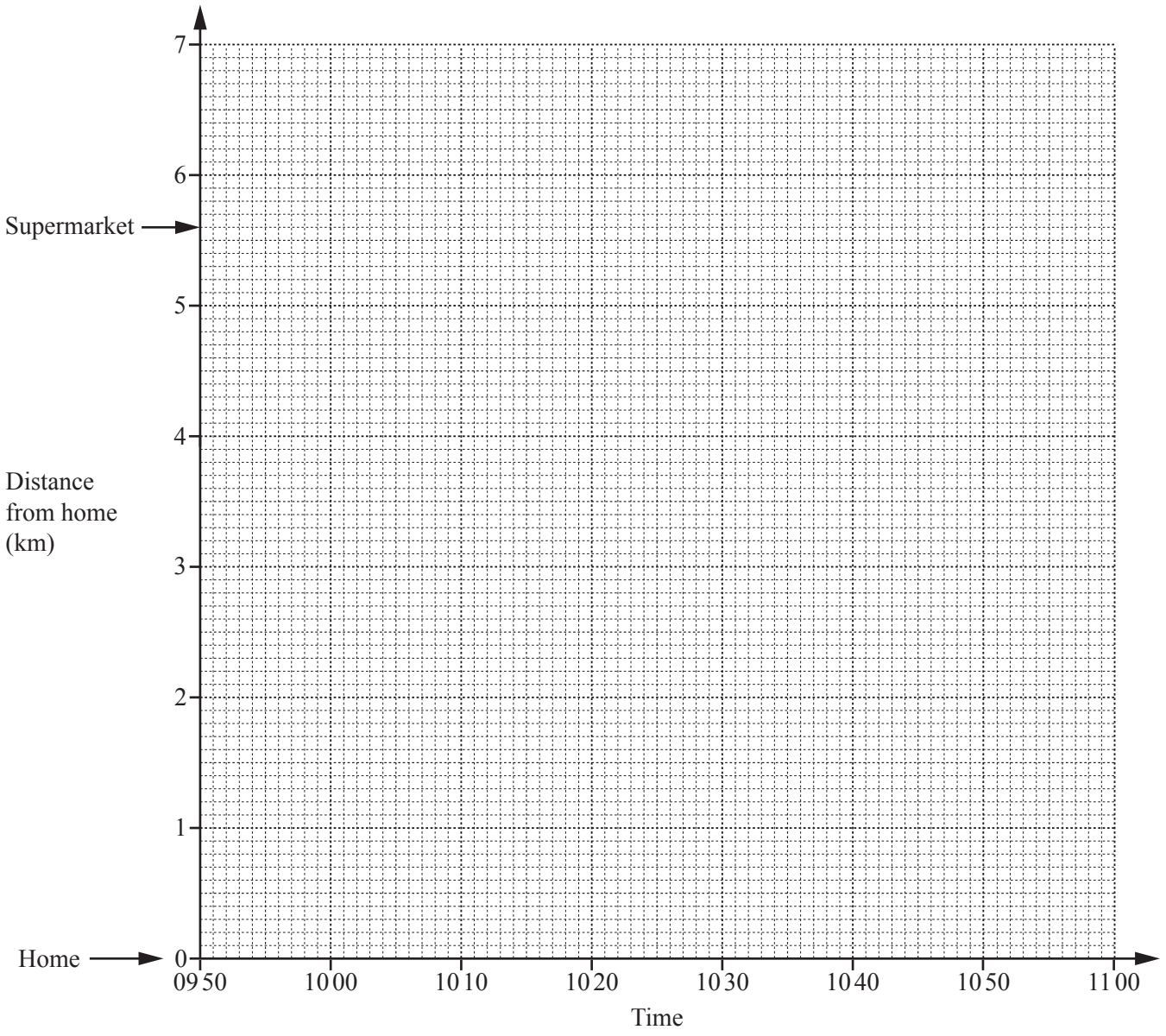
7
6
Supermarket
5
4
Distance from home (km)
3
2
1
Home
0
09 50
10 00
10 10
10 20
10 30
10 40
10 50
11 00
Time

8 (a)

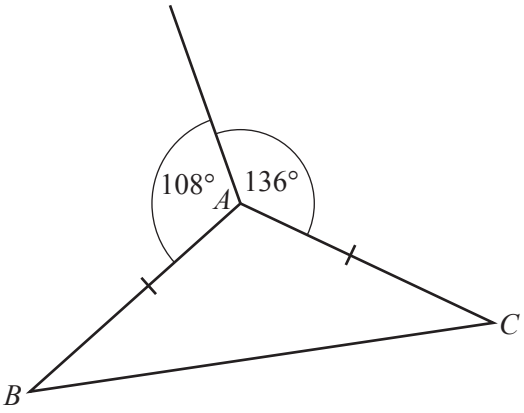

NOT TO SCALE

View solution

In the diagram, $AB = AC$.

Find

(i) angle BAC,

Angle BAC = ... [1]

(ii) angle ABC.

View solution

Angle ABC = ... [1]

© UCLES 2018

(b)

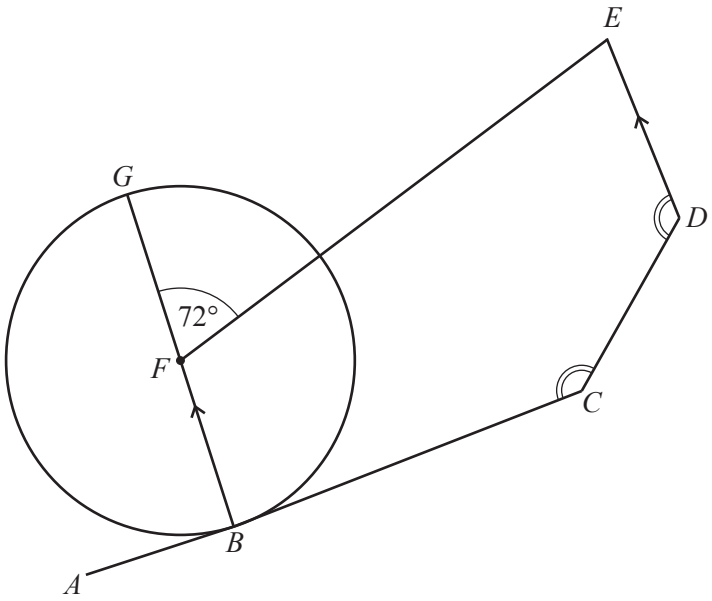

NOT TO SCALE

The diagram shows a circle, centre F and diameter BG.
AC is a tangent to the circle at B.
BF is parallel to DE, angle $GFE = 72°$ and angle BCD = angle CDE.

(i) Write down the mathematical name of the polygon $BCDEF$.

..... [1]

(ii) Explain why angle FBC is a right angle.

View solution

..... [1]

(iii) Find angle BFE, giving a reason for your answer.

View solution

Angle BFE =..... because .....

..... [2]

(iv) Find angle FED.

View solution

Angle FED = ... [1]

(v) Calculate angle BCD.

View solution

Angle BCD = ... [4]

Question 9 is printed on the next page.

© UCLES 2018

9 **(a)** Solve the equation $3(2x - 4) = 4(x + 7)$.

View solution

$x =$ ..... [3]

View solution

(b) Beindu goes to the market to buy apples and bananas.
She can buy

- 7 apples and 4 bananas for 85 cents

or

- 3 apples and 8 bananas for 93 cents.

Apples cost a cents each and bananas cost b cents each.

(i) This information can be used to write down two equations.
One of these is $7a + 4b = 85$.

Write down the other equation.

..... = ... [2]

View solution

(ii) Solve these two simultaneous equations.
You must show all your working.

$a =$ .....

$b =$ ..... [3]

Permission to reproduce items where third-party owned material protected by copyright is included has been sought and cleared where possible. Every reasonable effort has been made by the publisher (UCLES) to trace copyright holders, but if any items requiring clearance have unwittingly been included, the publisher will be pleased to make amends at the earliest possible opportunity.

To avoid the issue of disclosure of answer-related information to candidates, all copyright acknowledgements are reproduced online in the Cambridge International Examinations Copyright Acknowledgements Booklet. This is produced for each series of examinations and is freely available to download at www.cie.org.uk after the live examination series.

Cambridge International Examinations is part of the Cambridge Assessment Group. Cambridge Assessment is the brand name of University of Cambridge Local Examinations Syndicate (UCLES), which is itself a department of the University of Cambridge.

© UCLES 2018