Cambridge Assessment International Education

Cambridge IGCSE™

CANDIDATE NAME									
CENTRE NUMBER						CANDIDATE NUMBER			

MATHEMATICS **0580/12**

Paper 1 (Core) **May/June 2020**

1 hour

You must answer on the question paper.

You will need: Geometrical instruments

INSTRUCTIONS

- Answer **all** questions.
- Use a black or dark blue pen. You may use an HB pencil for any diagrams or graphs.
- Write your name, centre number and candidate number in the boxes at the top of the page.
- Write your answer to each question in the space provided.
- Do **not** use an erasable pen or correction fluid.
- Do **not** write on any bar codes.
- You should use a calculator where appropriate.
- You may use tracing paper.
- You must show all necessary working clearly.
- Give non-exact numerical answers correct to 3 significant figures, or 1 decimal place for angles in degrees, unless a different level of accuracy is specified in the question.
- For π, use either your calculator value or 3.142.

INFORMATION

- The total mark for this paper is 56.
- The number of marks for each question or part question is shown in brackets [ ].

© UCLES 2020

1 **(a)** Write in figures the number fifty-three thousand and thirty-five.

View solution

..... [1]

(b) Write 8379 correct to the nearest hundred.

View solution

..... [1]

2 **(a)**

View solution

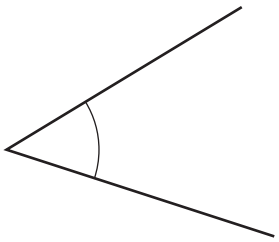

Write down the mathematical name for this type of angle.

..... [1]

(b)

View solution

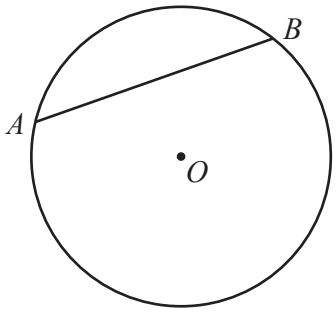

NOT TO SCALE

A and *B* lie on a circle, centre *O*.

(i) Write down the mathematical name for line *AB*.

..... [1]

(ii) $OA = 8\,\text{cm}$

View solution

Write down the length of the diameter of this circle.

..... cm [1]

3 Write down the reciprocal of 10.

View solution

..... [1]

4 **(a)** Find the value of $\sqrt{196}$.

View solution

..... [1]

(b) Calculate 15^3.

View solution

..... [1]

5 Put one pair of brackets in each statement to make it correct.

(a) 16 ÷ 8 + 4 × 2 = 1 [1]

View solution

(b) 16 ÷ 8 + 4 × 2 = 12 [1]

View solution

6 The 840 students in a school are asked if they want a change of school uniform.
The results are shown in the pie chart.

View solution

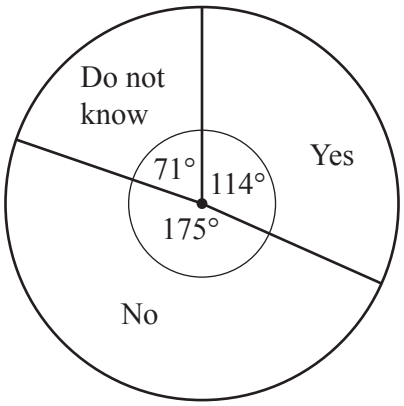

Show that the number of students who said Yes is 266.

[1]

7 Change 5.3 kilometres into metres.

View solution

..... m [1]

8 The scale drawing shows the positions of town *A* and town *B*.
The scale is 1 cm represents 12 kilometres.



Scale: 1 cm to 12 km

(a) Find the actual distance between town *A* and town *B*.

View solution

..... km [2]

(b) Town *C* is 72 km from town *A* and 96 km from town *B*.

On the scale drawing, construct the position of town *C*. [3]

View solution

9

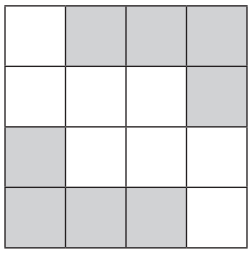

View solution

Write down the order of rotational symmetry of the diagram.

..... [1]

10

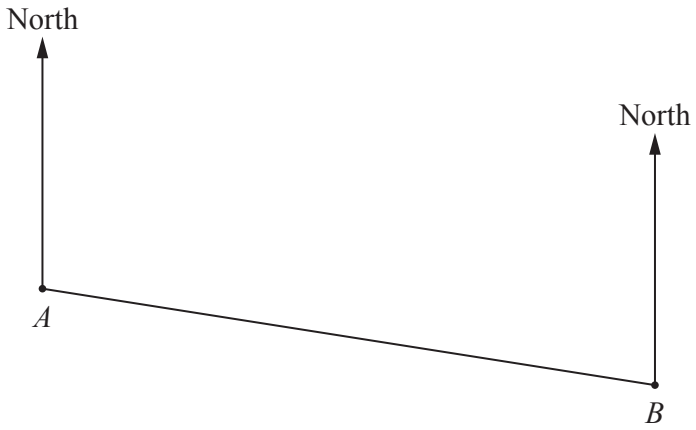

View solution

NOT TO SCALE

The bearing of B from A is 105°.

Find the bearing of A from B.

..... [2]

11 Write down

(a) a square number greater than 10,

View solution

..... [1]

(b) an irrational number.

..... [1]

View solution

12

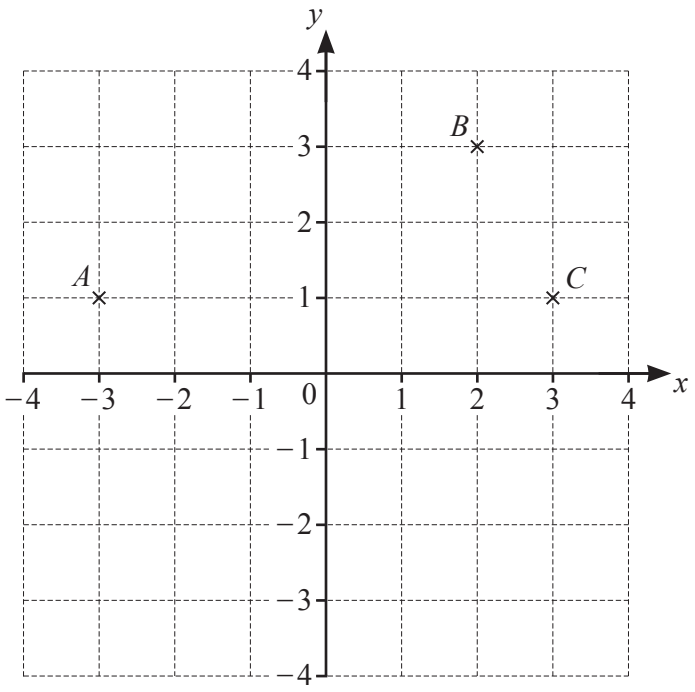

Points A, B and C are shown on the grid.

(a) Write down the coordinates of point C.

View solution

(..... , ...) [1]

(b) On the grid, plot point D so that $ABCD$ is a parallelogram. [1]

View solution

(c) On the grid, plot point E so that $\overrightarrow{EA} = \begin{pmatrix} -4 \\ 3 \end{pmatrix}$. [2]

View solution

13 The height, h metres, of a tower is 76.3 m, correct to 1 decimal place.

Complete this statement about the value of h.

View solution

..... $\leqslant h <$ ..... [2]

© UCLES 2020

14 Rovers, United and City are football teams.

View solution

Rovers scored x goals.
United scored 8 goals more than Rovers.
City scored 3 goals less than twice the number of goals scored by Rovers.

The three teams scored a total of 117 goals.

Write down and solve an equation to find the value of x.

$x =$ ..... [4]

15

View solution

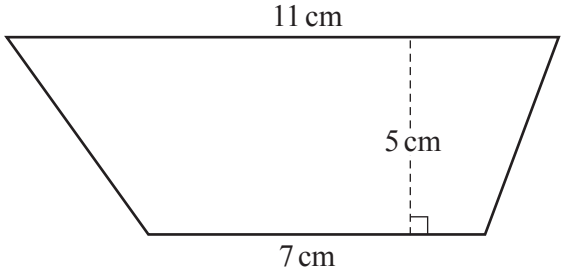

NOT TO SCALE

Calculate the area of the trapezium.

..... cm^2 [2]

16 (a)

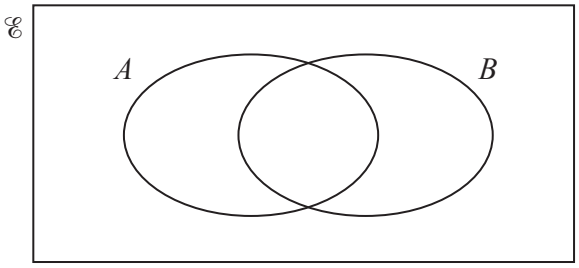

On the Venn diagram, shade the region $A \cap B$. [1]

(b) $\mathscr{E} = \{1, 2, 3, 4, 5, 6\}$
$P = \{x : x \text{ is an even number}\}$
$Q = \{x : x \text{ is a prime number}\}$

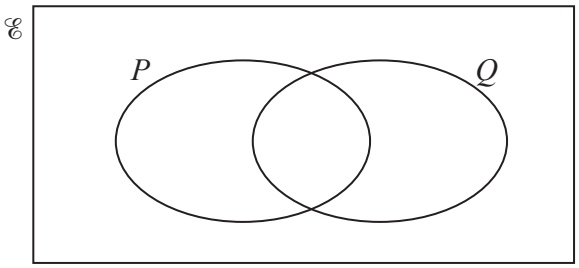

Complete the Venn diagram. [2]

17 Write 2^{-4} as a decimal.

..... [1]

18 **Without using a calculator**, work out $1\frac{3}{4} - \frac{11}{12}$.
You must show all your working and give your answer as a fraction in its simplest form.

View solution

..... [3]

19 Roberto buys a toy for \$5.00 .
He then sells it for \$4.60 .

Calculate his percentage loss.

View solution

..... % [2]

20 Simplify $8t^8 \div 4t^4$.

View solution

..... [2]

© UCLES 2020

21 **(a)** Write 45 000 in standard form.

View solution

..... [1]

(b) Write 2.06×10^{-2} as an ordinary number.

View solution

..... [1]

22 **(a)** Write down all the factors of 28.

View solution

..... [2]

(b) Write 54 as a product of its prime factors.

View solution

..... [2]

(c) Find the lowest common multiple (LCM) of 48 and 60.

View solution

..... [2]

© UCLES 2020

23

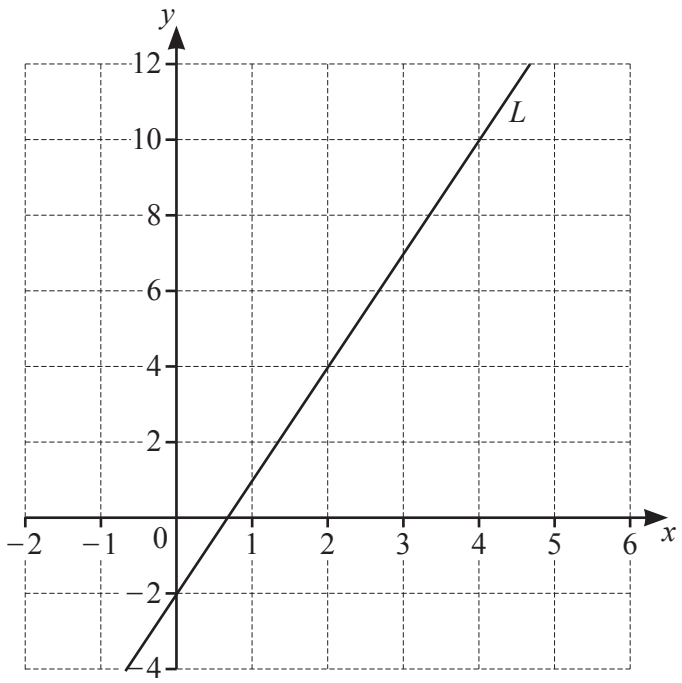

(a) Find the gradient of line L.

View solution

..... [2]

(b) Write down the equation of line L in the form $y = mx + c$.

View solution

$y =$ ..... [1]

BLANK PAGE

Permission to reproduce items where third-party owned material protected by copyright is included has been sought and cleared where possible. Every reasonable effort has been made by the publisher (UCLES) to trace copyright holders, but if any items requiring clearance have unwittingly been included, the publisher will be pleased to make amends at the earliest possible opportunity.

To avoid the issue of disclosure of answer-related information to candidates, all copyright acknowledgements are reproduced online in the Cambridge Assessment International Education Copyright Acknowledgements Booklet. This is produced for each series of examinations and is freely available to download at www.cambridgeinternational.org after the live examination series.

Cambridge Assessment International Education is part of the Cambridge Assessment Group. Cambridge Assessment is the brand name of the University of Cambridge Local Examinations Syndicate (UCLES), which itself is a department of the University of Cambridge.

© UCLES 2020