Cambridge Assessment International Education

Cambridge IGCSE™

CANDIDATE NAME									
CENTRE NUMBER						CANDIDATE NUMBER				

MATHEMATICS **0580/11**

Paper 1 (Core) **May/June 2021**

1 hour

You must answer on the question paper.

You will need: Geometrical instruments

INSTRUCTIONS

- Answer **all** questions.
- Use a black or dark blue pen. You may use an HB pencil for any diagrams or graphs.
- Write your name, centre number and candidate number in the boxes at the top of the page.
- Write your answer to each question in the space provided.
- Do **not** use an erasable pen or correction fluid.
- Do **not** write on any bar codes.
- You should use a calculator where appropriate.
- You may use tracing paper.
- You must show all necessary working clearly.
- Give non-exact numerical answers correct to 3 significant figures, or 1 decimal place for angles in degrees, unless a different level of accuracy is specified in the question.
- For π, use either your calculator value or 3.142.

INFORMATION

- The total mark for this paper is 56.
- The number of marks for each question or part question is shown in brackets [ ].

© UCLES 2021

1 Zachary asks the 30 students in his class which is their favourite sport.
The table shows the results.

View solution

Netball	Football	Hockey	Tennis
7	12	6	5

Complete the pictogram.

Netball	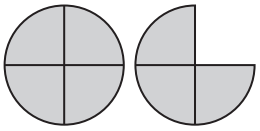
Football	
Hockey	
Tennis	

Key: 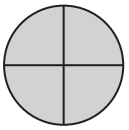 represents 4 people

[2]

2 **(a)** Find the value of $\sqrt{225}$.

View solution

..... [1]

(b) Write down the reciprocal of $\frac{2}{3}$.

View solution

..... [1]

(c) Work out three-quarters of one-third.

View solution

..... [1]

(d) Work out $-7-(6-8)$.

View solution

..... [1]

© UCLES 2021

3

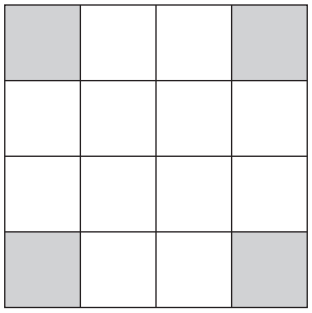

(a) Write down the order of rotational symmetry of this diagram.

View solution

..... [1]

(b) On the diagram, draw all the lines of symmetry. [2]

View solution

4 The stem-and-leaf diagram shows the number of hours that each of 16 students studied last week.

1	2	5	6	8	
2	0	1	1	7	9
3	2	3	4	5	
4	4	5	7		

Key: 1 | 2 represents 12 hours

Find

(a) the median,

View solution

..... h [1]

(b) the mode,

View solution

..... h [1]

(c) the range.

..... h [1]

View solution

5 The volume of a cuboid is $24\,cm^3$.
The base of the cuboid is 3 cm by 2 cm.

Draw a net of the cuboid on the $1\,cm^2$ grid.

View solution



[4]

6

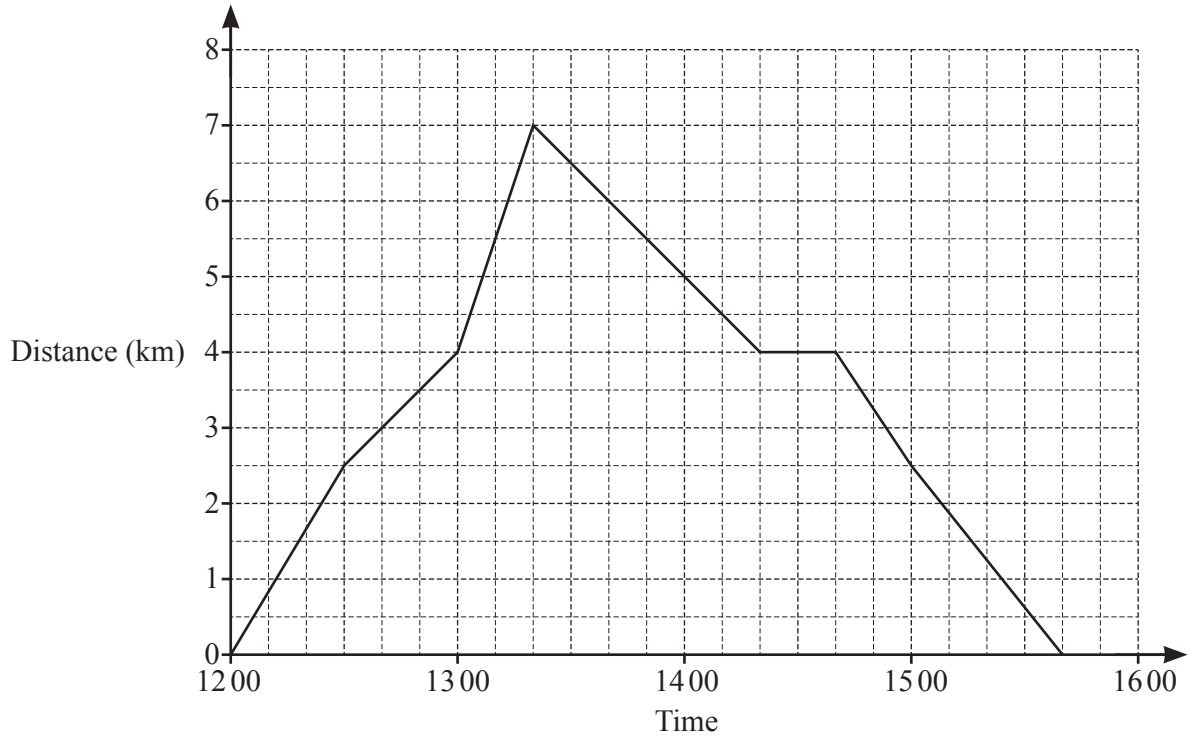

The travel graph shows a student's journey.

(a) Explain what is happening between 14 20 and 14 40.

View solution

..... [1]

(b) Complete the statement.

View solution

The student is travelling fastest between the times ..... and .....

because ..... [2]

7 The probability that a train is late is 0.15 .

View solution

Write down the probability that the train is not late.

..... [1]

© UCLES 2021

8 Nazaneen changes \$6500 into 5798 euros at a bank.

View solution

Work out the exchange rate the bank uses.

\$1 = ... euros [1]

9 Work out.

(a) $\begin{pmatrix} 6 \\ -5 \end{pmatrix} + \begin{pmatrix} 8 \\ -1 \end{pmatrix}$

View solution

$\begin{pmatrix} \quad \\ \quad \end{pmatrix}$ [1]

(b) $3\begin{pmatrix} -4 \\ 7 \end{pmatrix}$

View solution

$\begin{pmatrix} \quad \\ \quad \end{pmatrix}$ [1]

10

View solution

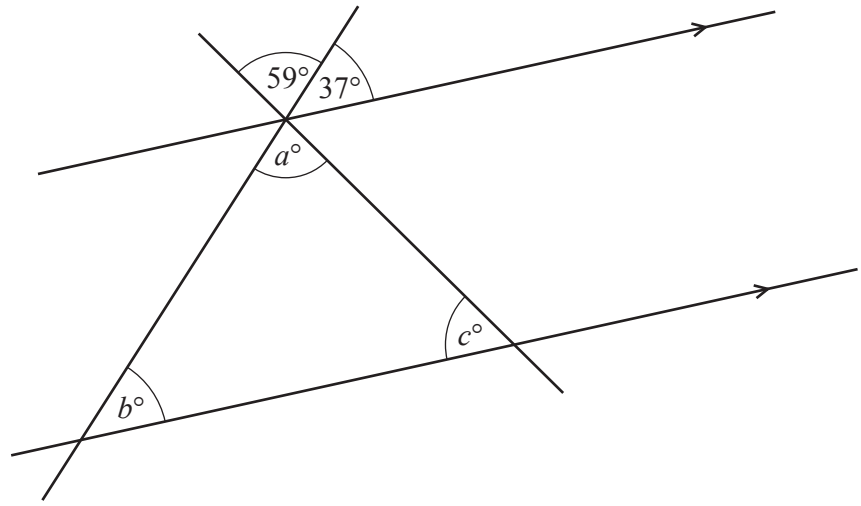

NOT TO SCALE

The diagram shows two parallel lines intersected by two straight lines.

Find the values of a, b and c.

a = ...

b = ...

c = ... [3]

11 **(a)** Write down the mathematical name for a polygon with 5 sides.

View solution

..... [1]

(b) Work out the interior angle of a regular 18-sided polygon.

View solution

..... [2]

12 The nth term of a sequence is $6n - 4$.

(a) Write down the first 3 terms in this sequence.

View solution

....., ..., ... [1]

(b) The kth term of this sequence is 422.

Work out the value of k.

View solution

$k =$ ..... [2]

13 The radius of a circle is 42 cm.

Work out the circumference of the circle.
Give your answer in terms of π.

View solution

..... cm [2]

© UCLES 2021

14 Change $680\,000\,\text{cm}^3$ into m^3.

View solution

..... m^3 [1]

15 The length, l metres, of a piece of rope is 5.67 m, correct to the nearest centimetre.

View solution

Complete this statement about the value of l.

..... $\leqslant l <$ ..... [2]

16 **Without using a calculator**, work out $1\frac{3}{8} - \frac{5}{6}$.

View solution

You must show all your working and give your answer as a fraction in its simplest form.

..... [3]

© UCLES 2021

17 **(a)** Write $\frac{1}{2\times2\times2\times2\times2}$ as a power of 2.

View solution

..... [1]

(b) **(i)** $3^{18} \div 3^{t} = 3^{6}$

View solution

Find the value of t.

$t =$ ..... [1]

(ii) Simplify.

View solution

$8w^{10} \times 6w^{5}$

..... [2]

18 Annie invests \$8300 at a rate of 5.6% per year compound interest.

View solution

Calculate the value of her investment at the end of 6 years.

\$ ..... [2]

19 Write down an irrational number, n, where $31 < n < 32$.

View solution

$n =$ ..... [1]

© UCLES 2021

20 By rounding each number in the calculation correct to 1 significant figure, estimate the value of

$$\frac{38.7 \times 3.115}{20.3 - 4.1^2}.$$

View solution

You must show all your working.

..... [2]

21 Solve the simultaneous equations.
You must show all your working.

View solution

$$2x + y = 3$$
$$x - 5y = 40$$

$x =$ .....

$y =$ ..... [3]

22 There is a straight road between town A and town B of length 130 km.

View solution

Maxi travels from town A to town B.
Pippa travels from town B to town A.
Both travel at a constant speed of 40 km/h.
Maxi leaves 30 minutes before Pippa.

Work out how far from town A they will be when they pass each other.

..... km [4]

BLANK PAGE

Permission to reproduce items where third-party owned material protected by copyright is included has been sought and cleared where possible. Every reasonable effort has been made by the publisher (UCLES) to trace copyright holders, but if any items requiring clearance have unwittingly been included, the publisher will be pleased to make amends at the earliest possible opportunity.

To avoid the issue of disclosure of answer-related information to candidates, all copyright acknowledgements are reproduced online in the Cambridge Assessment International Education Copyright Acknowledgements Booklet. This is produced for each series of examinations and is freely available to download at www.cambridgeinternational.org after the live examination series.

Cambridge Assessment International Education is part of the Cambridge Assessment Group. Cambridge Assessment is the brand name of the University of Cambridge Local Examinations Syndicate (UCLES), which itself is a department of the University of Cambridge.

© UCLES 2021