Cambridge Assessment International Education

Cambridge IGCSE™

CANDIDATE NAME									
CENTRE NUMBER						CANDIDATE NUMBER				

MATHEMATICS **0580/13**

Paper 1 (Core) **May/June 2022**

1 hour

You must answer on the question paper.

You will need: Geometrical instruments

INSTRUCTIONS

- Answer **all** questions.
- Use a black or dark blue pen. You may use an HB pencil for any diagrams or graphs.
- Write your name, centre number and candidate number in the boxes at the top of the page.
- Write your answer to each question in the space provided.
- Do **not** use an erasable pen or correction fluid.
- Do **not** write on any bar codes.
- You should use a calculator where appropriate.
- You may use tracing paper.
- You must show all necessary working clearly.
- Give non-exact numerical answers correct to 3 significant figures, or 1 decimal place for angles in degrees, unless a different level of accuracy is specified in the question.
- For π, use either your calculator value or 3.142.

INFORMATION

- The total mark for this paper is 56.
- The number of marks for each question or part question is shown in brackets [ ].

© UCLES 2022

1 Write the number one hundred and three thousand eight hundred and six in figures.

..... [1]

View solution

2

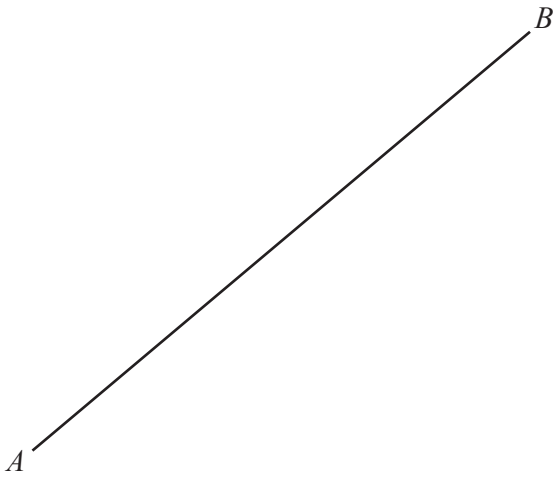

(a) Measure the length of the line AB in millimetres.

View solution

..... mm [1]

(b) Mark the midpoint, M, of the line AB. [1]

View solution

(c) Draw a line through M that is perpendicular to the line AB. [1]

View solution

3 Simplify.

$$3x - 4x + 7x$$

View solution

..... [1]

4 Work out the area of a rectangle that is 9.5 m long and 6.8 m wide.

View solution

..... m^2 [2]

5 The probability of picking a red sweet from a bag is 0.05 .

View solution

Find the probability of not picking a red sweet.

..... [1]

© UCLES 2022

6

View solution

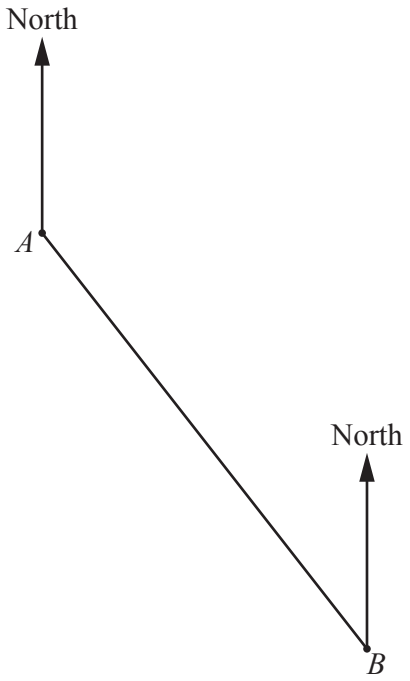

Measure the bearing of point B from point A.

..... [1]

7 Work out the value of $\frac{mk^3}{\sqrt{3}}$ when $m = 4$ and $k = 7$.

View solution

..... [2]

8 A box, in the shape of a cuboid, has volume 357 cm^3.
It has a length of 8.5 cm and a width of 6 cm.

View solution

Calculate the height of the box.

..... cm [2]

© UCLES 2022

9

View solution

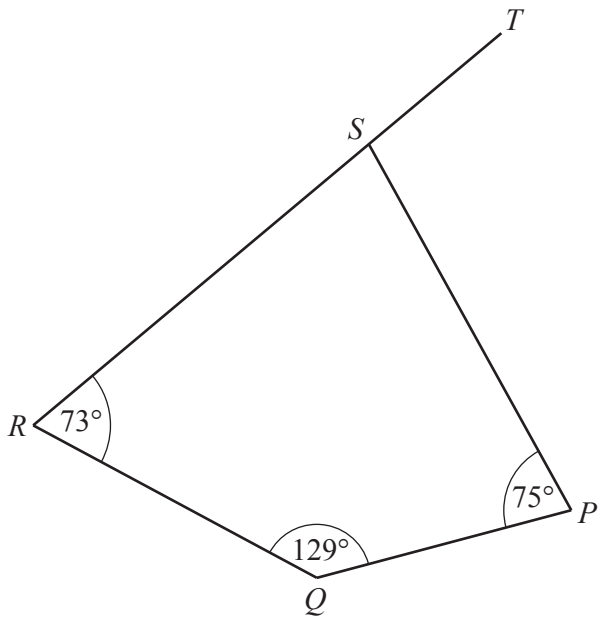

NOT TO SCALE

PQRS is a quadrilateral.
RST is a straight line.

Find angle *PST*.

Angle *PST* = ... [2]

10 These are the masses, in kg, of 12 parcels.

0.3 0.4 1.2 0.8 1.1 2.1 1.7 1.8 1.2 2.3 0.7 1.1

View solution

(a) Complete the stem-and-leaf diagram for the 12 parcels.

0	3 4
1	
2	

Key: 0 | 3 represents 0.3 kg

[2]

View solution

(b) Find the median.

..... kg [1]

© UCLES 2022

11 The grid shows point P and point R.

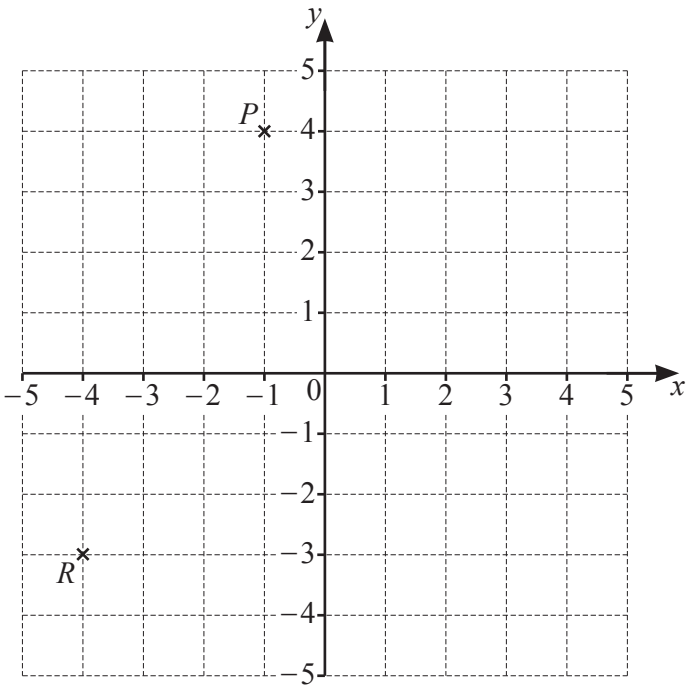

(a) Write down the coordinates of point P.

View solution

(..... , ...) [1]

(b) $\overrightarrow{PQ} = \begin{pmatrix} 3 \\ -2 \end{pmatrix}$

View solution

Mark point Q on the grid. [1]

(c) Find $\overrightarrow{QR}$.

View solution

$\overrightarrow{QR} = \begin{pmatrix} \quad \\ \quad \end{pmatrix}$ [1]

(d) Complete this statement.

$\overrightarrow{PQ} + \overrightarrow{QR} =$ ..... [1]

View solution

12 Simplify.

(a) $y^3 \div y^5$

View solution

..... [1]

(b) $7x^0$

..... [1]

View solution

13 The scatter diagram shows the number of visitors and the total amount spent, in thousands of dollars, at a zoo on each of eight days.

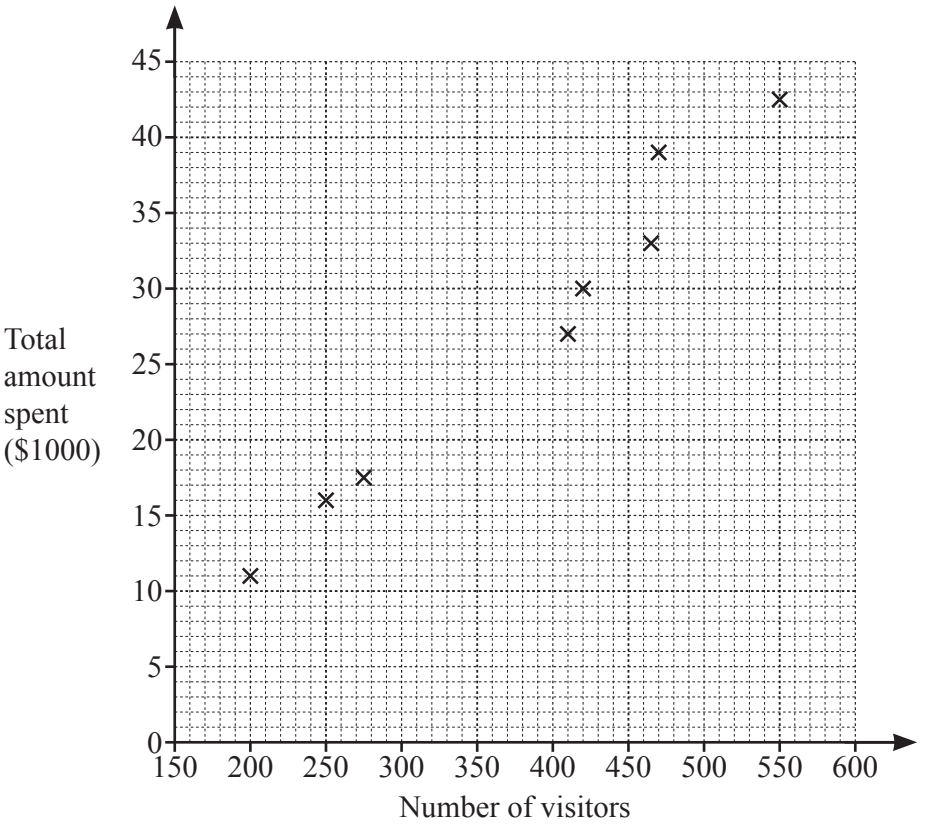

(a) On one of the eight days there are 410 visitors.

View solution

Find the total amount spent by visitors during this day.

$ ..... [1]

(b) Information for the ninth day is shown in the table.

View solution

Number of visitors	175
Total amount spent ($1000)	9

Plot this information on the scatter diagram. [1]

View solution

(c) Draw a line of best fit on the scatter diagram. [1]

(d) On the tenth day the total amount spent is $22 000.

View solution

Estimate the number of visitors on this day.

..... [1]

14

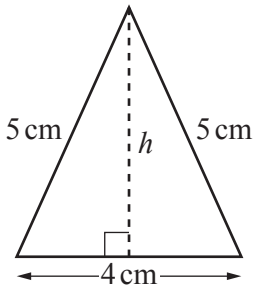

NOT TO SCALE

(a) Calculate the height, h, of the triangle.

View solution

$h =$ ..... cm [3]

(b) The triangle is one face of a square-based pyramid.

On the 1 cm^2 grid, draw a net of this pyramid.

View solution

[3]

15 Factorise completely.

$$18px - 27p$$

View solution

..... [2]

16 The nth term of a sequence is $n^2 - 1$.

View solution

Find the first three terms of this sequence.

..... , ... , ... [2]

17

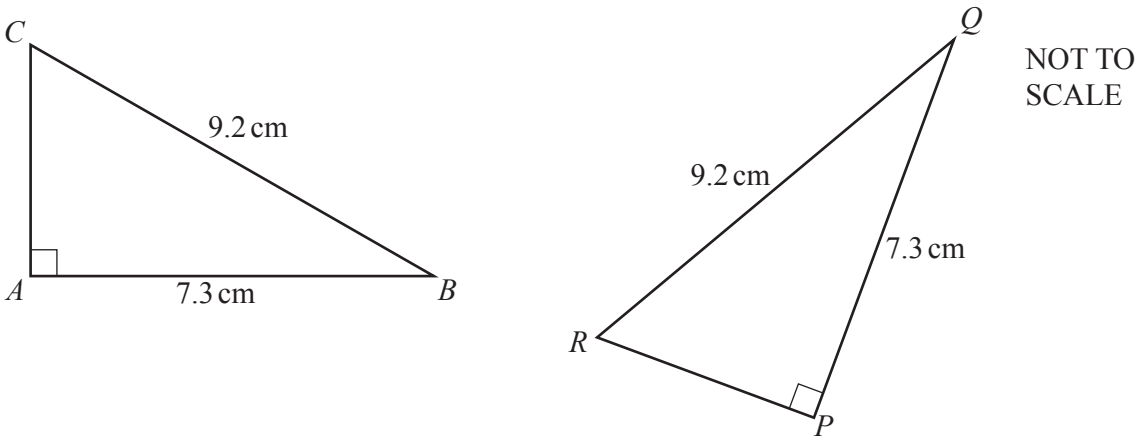

The diagram shows two right-angled triangles, ABC and PQR.

(a) Complete this statement with a geometrical term.

View solution

Triangle ABC is ..... to triangle PQR. [1]

(b) Calculate angle ABC.

View solution

Angle ABC = ... [2]

18 Find the lowest common multiple (LCM) of 32 and 40.

View solution

..... [2]

19 Joe thinks of a number, n, trebles it, and subtracts 5.
The result is 22.

Write this as an equation in terms of n, and solve the equation.

View solution

$n =$ ..... [3]

20

View solution

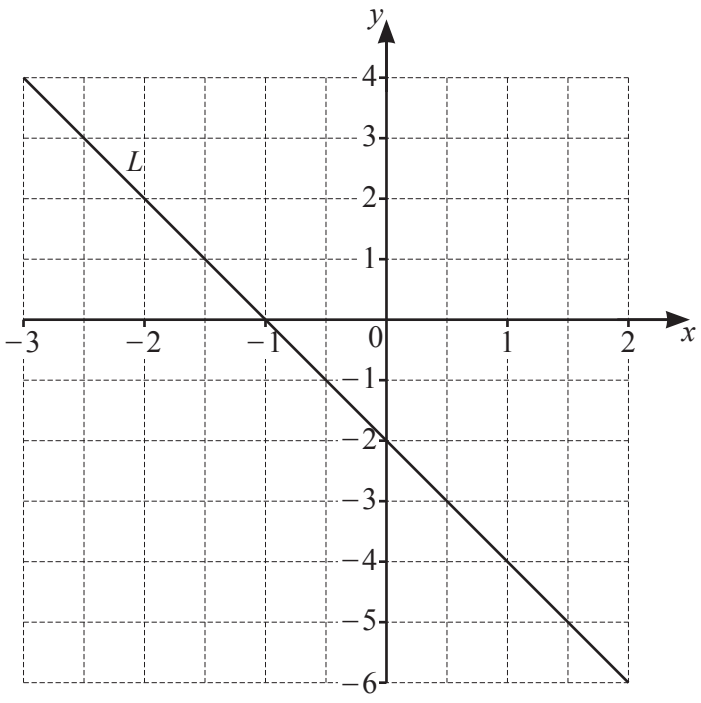

Find the gradient of line L.

..... [2]

21 Dominic asks 30 students in his class if they are right-handed or left-handed.
7 students are left-handed.

View solution

Work out the expected number of left-handed students in the whole school of 960 students.

..... [2]

22 **Without using a calculator**, work out $4\frac{1}{6} - 1\frac{7}{8}$.

View solution

You must show all your working and give your answer as a mixed number in its simplest form.

..... [3]

23 Solve the simultaneous equations.
You must show all your working.

View solution

$$4x - 3y = 26$$
$$5x + 6y = 13$$

$x =$ .....

$y =$ ..... [3]

© UCLES 2022

BLANK PAGE

BLANK PAGE

Permission to reproduce items where third-party owned material protected by copyright is included has been sought and cleared where possible. Every reasonable effort has been made by the publisher (UCLES) to trace copyright holders, but if any items requiring clearance have unwittingly been included, the publisher will be pleased to make amends at the earliest possible opportunity.

To avoid the issue of disclosure of answer-related information to candidates, all copyright acknowledgements are reproduced online in the Cambridge Assessment International Education Copyright Acknowledgements Booklet. This is produced for each series of examinations and is freely available to download at www.cambridgeinternational.org after the live examination series.

Cambridge Assessment International Education is part of Cambridge Assessment. Cambridge Assessment is the brand name of the University of Cambridge Local Examinations Syndicate (UCLES), which is a department of the University of Cambridge.

© UCLES 2022