Cambridge Assessment International Education

Cambridge IGCSE™

CANDIDATE NAME									
CENTRE NUMBER						CANDIDATE NUMBER				

MATHEMATICS **0580/21**

Paper 2 (Extended) **May/June 2022**

1 hour 30 minutes

You must answer on the question paper.

You will need: Geometrical instruments

INSTRUCTIONS

- Answer **all** questions.
- Use a black or dark blue pen. You may use an HB pencil for any diagrams or graphs.
- Write your name, centre number and candidate number in the boxes at the top of the page.
- Write your answer to each question in the space provided.
- Do **not** use an erasable pen or correction fluid.
- Do **not** write on any bar codes.
- You should use a calculator where appropriate.
- You may use tracing paper.
- You must show all necessary working clearly.
- Give non-exact numerical answers correct to 3 significant figures, or 1 decimal place for angles in degrees, unless a different level of accuracy is specified in the question.
- For π, use either your calculator value or 3.142.

INFORMATION

- The total mark for this paper is 70.
- The number of marks for each question or part question is shown in brackets [ ].

This document has **12** pages. Any blank pages are indicated.

© UCLES 2022

1 Write down a prime number between 30 and 40.

View solution

..... [1]

2 Calculate $4^5 - 5^4$.

View solution

..... [1]

3 Jason starts a run at 10.05 am and finishes at 1.02 pm.

Work out the time Jason takes to complete the run.

View solution

..... h ..... min [1]

4 Calculate $\frac{1-0.7}{0.45-0.38}$, giving your answer correct to 4 significant figures.

View solution

..... [2]

5 Kirsty changes \$380.80 into pounds (£) when £1 = \$1.19.

Calculate the amount Kirsty receives.

View solution

£ ..... [2]

6 Write 180 as a product of its prime factors.

View solution

..... [2]

© UCLES 2022

7 **Without using a calculator**, work out $\frac{3}{7} - \frac{2}{21}$.

View solution

You must show all your working and give your answer as a fraction in its simplest form.

..... [2]

8 $s = \frac{1}{2}at^2$

(a) Work out the value of s when $a = 0.9$ and $t = 4$.

View solution

$s =$ ..... [1]

(b) Rearrange the formula to find t in terms of s and a.

View solution

$t =$ ..... [2]

9 Factorise completely.

$$14xy - 7y^2$$

View solution

..... [2]

10 22, 17, 12, 7, 2, …

(a) Find the next term of the sequence.

View solution

..... [1]

(b) Find the nth term of the sequence.

View solution

..... [2]

11

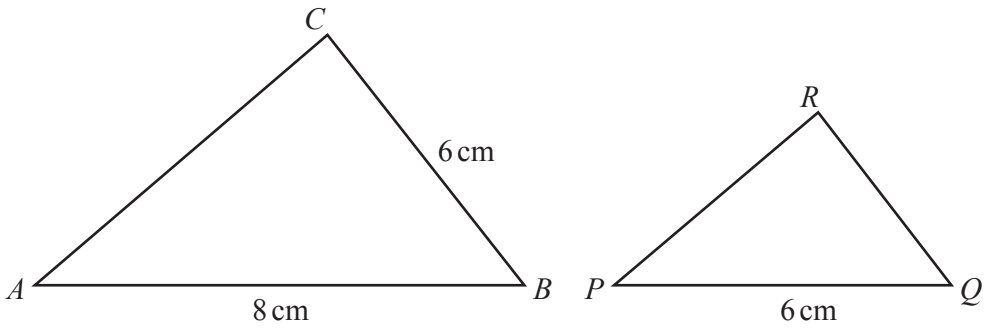

NOT TO SCALE

Triangle ABC is mathematically similar to triangle PQR.

(a) Calculate QR.

View solution

$QR =$ ..... cm [2]

(b) The two triangles are the cross-sections of two mathematically similar prisms.
The volume of the larger prism is $320\,\text{cm}^3$.

View solution

Calculate the volume of the smaller prism.

..... cm^3 [2]

© UCLES 2022

12 The interior angles of a pentagon are in the ratio $4 : 5 : 5 : 7 : 9$.

Find the size of the largest angle.

View solution

..... [3]

13 Work out $2 \times 10^{100} - 2 \times 10^{98}$, giving your answer in standard form.

View solution

..... [2]

14 A train passes through a station at a speed of 108 km/h.
The length of the station is 120 m.
The train takes 7 seconds to completely pass through the station.

Work out the length of the train.

View solution

..... m [3]

15 $4^x = \frac{1}{64}$

View solution

Find the value of x.

$x =$ ..... [1]

16

View solution

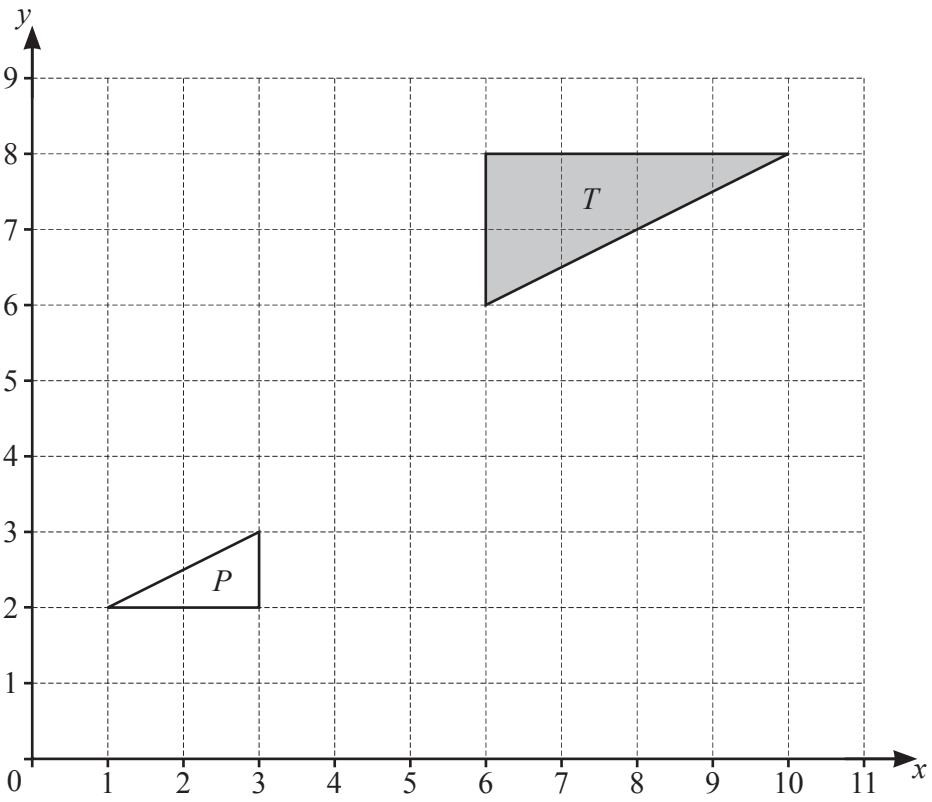

Describe fully the **single** transformation that maps triangle T onto triangle P.

.....

..... [3]

17 Find the radius of a hemisphere of volume $80\,\text{cm}^3$.

View solution

[The volume, V, of a sphere with radius r is $V = \frac{4}{3}\pi r^3$.]

..... cm [3]

© UCLES 2022

18

View solution

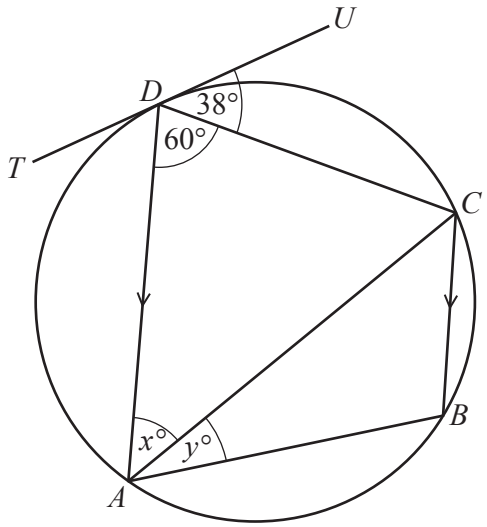

NOT TO SCALE

A, B, C and D are points on a circle.
TU is a tangent to the circle at D.
DA is parallel to CB.

Find the value of x and the value of y.

$x =$ .....

$y =$ ..... [3]

19

View solution

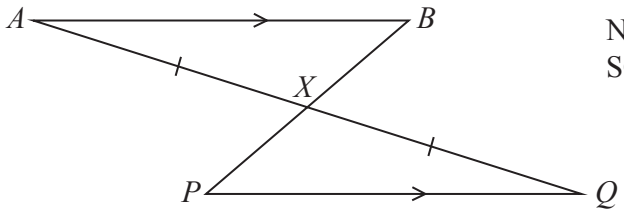

NOT TO SCALE

In the diagram, AB is parallel to PQ.
AQ and PB intersect at X with $AX = XQ$.

Complete the following statements.

In triangles ABX and QPX,

$AX = XQ$ is given information.

Angle BAX = Angle ..... because .....

Angle AXB = Angle ..... because .....

Triangle ABX is congruent to triangle QPX because of the congruency criterion .....

PX = ... because the triangles are congruent. [4]

© UCLES 2022

20

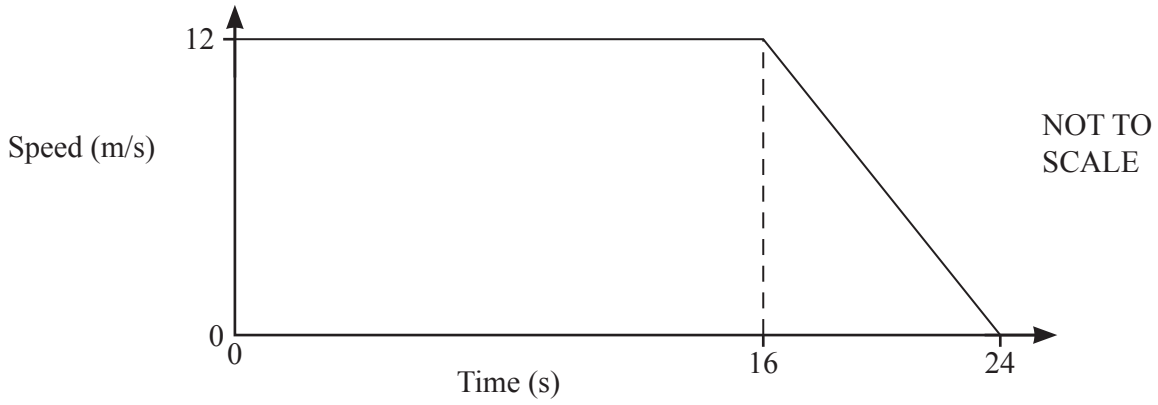

The diagram shows the speed–time graph for 24 seconds of a car journey.

Calculate

(a) the deceleration of the car in the final 8 seconds,

View solution

..... m/s^2 [1]

(b) the total distance travelled during the 24 seconds.

View solution

..... m [2]

21 Factorise completely.

$1 - q - a + aq$

View solution

..... [2]

22 Simplify fully $(216y^{216})^{\frac{2}{3}}$.

View solution

..... [2]

23 $x^2 + 8x + 10 = (x+p)^2 + q$

(a) Find the value of p and the value of q.

View solution

$p =$ .....

$q =$ ..... [2]

(b) Solve.

$$x^2 + 8x + 10 = 30$$

View solution

$x =$ ..... or $x =$ ..... [2]

24 A cuboid measures 24 cm by 12 cm by 8 cm.

View solution

Calculate the length of a diagonal of the cuboid.

..... cm [3]

© UCLES 2022

25 w is proportional to the square root of y.
y is inversely proportional to x.
When $x = 4$, $y = 16$ and $w = 8$.

View solution

Find w in terms of x.

$w =$ ..... [3]

26

View solution

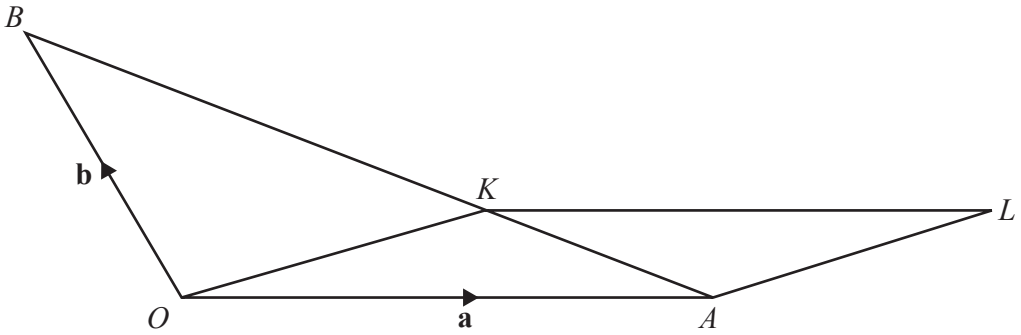

NOT TO SCALE

The diagram shows a triangle OAB and a parallelogram $OALK$.
The position vector of A is **a** and the position vector of B is **b**.
K is a point on AB so that $AK : KB = 1 : 2$.

Find the position vector of L, in terms of **a** and **b**.
Give your answer in its simplest form.

..... [4]

27 The line $y = x + 1$ intersects the graph of $y = x^2 - 3x - 11$ at the points A and B.

View solution

Find the coordinates of A and the coordinates of B.
You must show all your working.

A (..... , ...)

B (..... , ...) [4]

BLANK PAGE

Permission to reproduce items where third-party owned material protected by copyright is included has been sought and cleared where possible. Every reasonable effort has been made by the publisher (UCLES) to trace copyright holders, but if any items requiring clearance have unwittingly been included, the publisher will be pleased to make amends at the earliest possible opportunity.

To avoid the issue of disclosure of answer-related information to candidates, all copyright acknowledgements are reproduced online in the Cambridge Assessment International Education Copyright Acknowledgements Booklet. This is produced for each series of examinations and is freely available to download at www.cambridgeinternational.org after the live examination series.

Cambridge Assessment International Education is part of Cambridge Assessment. Cambridge Assessment is the brand name of the University of Cambridge Local Examinations Syndicate (UCLES), which is a department of the University of Cambridge.

© UCLES 2022