Cambridge Assessment International Education

Cambridge IGCSE™

CANDIDATE NAME									
CENTRE NUMBER						CANDIDATE NUMBER				

MATHEMATICS **0580/22**

Paper 2 (Extended) **May/June 2023**

1 hour 30 minutes

You must answer on the question paper.

You will need: Geometrical instruments

INSTRUCTIONS

- Answer **all** questions.
- Use a black or dark blue pen. You may use an HB pencil for any diagrams or graphs.
- Write your name, centre number and candidate number in the boxes at the top of the page.
- Write your answer to each question in the space provided.
- Do **not** use an erasable pen or correction fluid.
- Do **not** write on any bar codes.
- You should use a calculator where appropriate.
- You may use tracing paper.
- You must show all necessary working clearly.
- Give non-exact numerical answers correct to 3 significant figures, or 1 decimal place for angles in degrees, unless a different level of accuracy is specified in the question.
- For π, use either your calculator value or 3.142.

INFORMATION

- The total mark for this paper is 70.
- The number of marks for each question or part question is shown in brackets [ ].

This document has **12** pages.

© UCLES 2023

1 Find the temperature that is 8 °C colder than −5 °C.

View solution

..... °C [1]

2 There are two prime numbers in this list.

View solution

27 47 57 61 75 93

Work out the sum of these two prime numbers.

..... [2]

3 On ten days, Stefan records the number of minutes he has to wait for a train.

1 3 12 5 4 23 5 24 11 8

(a) Complete the stem-and-leaf diagram to show this information.

View solution

0	1 3
1	
2	

Key: 0 | 1 represents 1 minute

[2]

(b) Find the median.

View solution

..... min [1]

4 The distance from town *A* to town *B* on a map is 3.5 cm.
The scale on the map is 1 : 250 000.

View solution

Find the actual distance, in kilometres, from town *A* to town *B*.

..... km [2]

© UCLES 2023

5 A spinner is spun.
The possible outcomes are A, B, C or D.
The probability of spinning A, C or D is shown in the table.

View solution

Letter on spinner	A	B	C	D
Probability	0.2		0.05	0.35

Complete the table.

[2]

6 $\mathscr{E} = \{x: 1 \leqslant x \leqslant 20\}$
$E = \{\text{even numbers}\}$
$M = \{\text{multiples of 5}\}$

(a) Find $\text{n}(M)$.

View solution

..... [1]

(b) Find the elements in the set $E \cap M$.

View solution

..... [1]

(c) $y \notin E$.

Write down a possible value of y.

View solution

..... [1]

© UCLES 2023

7 **Without using a calculator**, work out $\frac{4}{7} \div 1\frac{5}{21}$.
You must show all your working and give your answer as a fraction in its simplest form.

View solution

..... [3]

8 Solve.

(a) $\frac{30}{x} = 6$

View solution

$x =$ ..... [1]

(b) $11x - 3 \geqslant 2(2x + 9)$

View solution

..... [3]

9 F is the point $(1, -4)$, $\overrightarrow{FG} = \begin{pmatrix} 8 \\ -3 \end{pmatrix}$ and $\overrightarrow{GH} = \begin{pmatrix} -12 \\ 35 \end{pmatrix}$.

Find

(a) $3\overrightarrow{FG}$

View solution

( ) [1]

(b) $\overrightarrow{FG} + \overrightarrow{GH}$

View solution

( ) [1]

(c) the coordinates of the point G

View solution

(..... , ...) [1]

(d) the magnitude of vector $\overrightarrow{GH}$.

View solution

..... [2]

© UCLES 2023

10

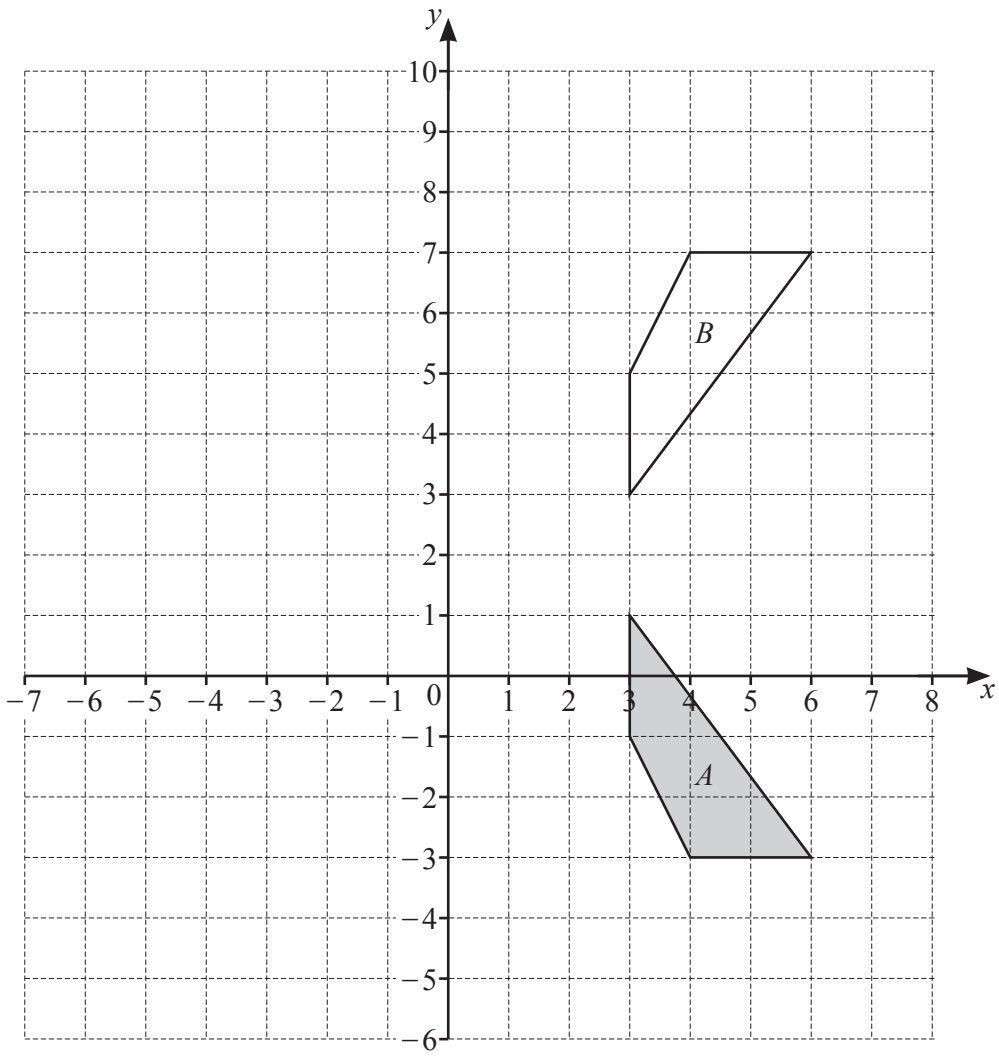

(a) Describe fully the **single** transformation that maps shape *A* onto shape *B*.

View solution

.....

..... [2]

(b) Rotate shape *A* 90° clockwise about the point (−1, 2). View solution [2]

(c) Enlarge shape *A* by scale factor −2, centre (2, 0). [2]

View solution

11

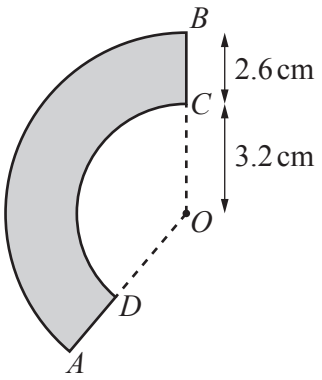

NOT TO SCALE

The diagram shows a shape, $ABCD$, formed by the sectors of two circles with the same centre O.
Both sector angles are 140°, $OC = 3.2$ cm and $CB = 2.6$ cm.
The area of the shape is $k\pi$ cm^2.

Find the value of k.

$k =$ ..... [3]

12 One solution of the equation $ax^2 + b = 181$ is $x = 8$.
a and b are both positive integers **greater than 1**.

(a) Find the value of b.

$b =$ ..... [2]

(b) Write down the other solution of the equation $ax^2 + b = 181$.

$x =$ ..... [1]

13

View solution

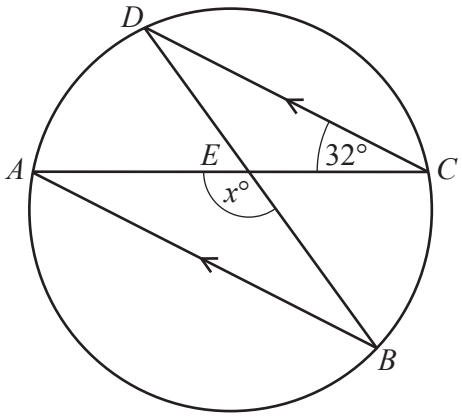

NOT TO SCALE

A, B, C and D are points on a circle.
AB is parallel to DC and angle $ACD = 32°$.
Chords AC and DB intersect at E.

Find the value of x.

$x =$ ..... [2]

14 $f(x) = 5x + 2$

View solution

Find $f^{-1}(x)$.

$f^{-1}(x) =$ ..... [2]

© UCLES 2023

15 C is the point $(5, -1)$ and D is the point $(13, 15)$.

(a) Find the midpoint of CD.

View solution

(..... , ...) [2]

(b) Find the gradient of CD.

View solution

..... [2]

(c) Find the equation of the perpendicular bisector of CD.
Give your answer in the form $y = mx + c$.

View solution

$y =$ ..... [3]

16 Write $0.62\dot{1}$ as a fraction in its simplest form.
You must show all your working.

View solution

..... [3]

© UCLES 2023

17

View solution

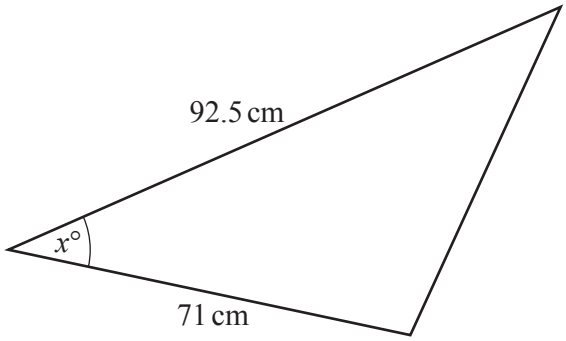

NOT TO SCALE

The diagram shows a triangle with an acute angle marked $x°$.
The area of the triangle is $2143\,\text{cm}^2$.

Work out the value of x.

$x =$ ..... [2]

18 Make x the subject of the formula.

View solution

$$c = \frac{3x}{2x-5}$$

$x =$ ..... [4]

19 m is inversely proportional to the square of $(t+2)$.
$m = 0.64$ when $t = 3$.

View solution

Find m when $t = 8$.

$m =$ ..... [3]

20 In the Venn diagram, shade the region $A \cap B' \cap C$.

View solution

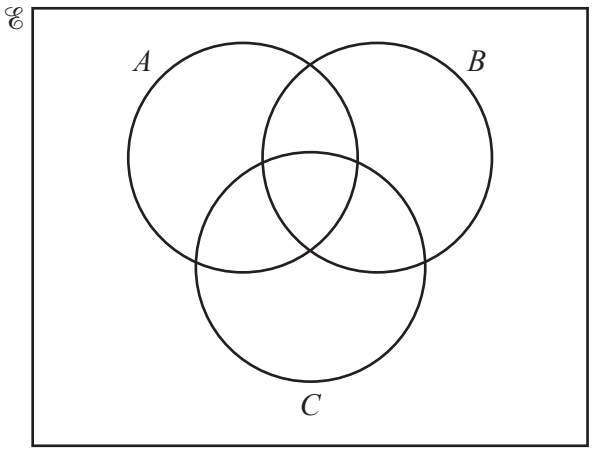

[1]

21 Solve the equation $5\sin x = -3$ for $0° \leqslant x \leqslant 360°$.

View solution

..... [3]

Questions 22 and 23 are printed on the next page.

22 Write as a single fraction in its simplest form.

View solution

$$\frac{5}{3x+2}+\frac{4}{2x-1}$$

..... [3]

View solution

23 Bag A and bag B each contain red sweets and yellow sweets.
Anna picks a sweet at random from bag A.
Ben picks a sweet at random from bag B.
The probability that Anna picks a red sweet is $\frac{2}{5}$.
The probability Anna and Ben both pick a yellow sweet is $\frac{1}{10}$.

Find the probability that Anna and Ben both pick a red sweet.

..... [3]

Permission to reproduce items where third-party owned material protected by copyright is included has been sought and cleared where possible. Every reasonable effort has been made by the publisher (UCLES) to trace copyright holders, but if any items requiring clearance have unwittingly been included, the publisher will be pleased to make amends at the earliest possible opportunity.

To avoid the issue of disclosure of answer-related information to candidates, all copyright acknowledgements are reproduced online in the Cambridge Assessment International Education Copyright Acknowledgements Booklet. This is produced for each series of examinations and is freely available to download at www.cambridgeinternational.org after the live examination series.

Cambridge Assessment International Education is part of Cambridge Assessment. Cambridge Assessment is the brand name of the University of Cambridge Local Examinations Syndicate (UCLES), which is a department of the University of Cambridge.

© UCLES 2023