Cambridge Assessment International Education

Cambridge IGCSE™

CANDIDATE NAME									
CENTRE NUMBER						CANDIDATE NUMBER				

MATHEMATICS **0580/12**

Paper 1 (Core) **May/June 2024**

1 hour

You must answer on the question paper.

You will need: Geometrical instruments

INSTRUCTIONS

- Answer **all** questions.
- Use a black or dark blue pen. You may use an HB pencil for any diagrams or graphs.
- Write your name, centre number and candidate number in the boxes at the top of the page.
- Write your answer to each question in the space provided.
- Do **not** use an erasable pen or correction fluid.
- Do **not** write on any bar codes.
- You should use a calculator where appropriate.
- You may use tracing paper.
- You must show all necessary working clearly.
- Give non-exact numerical answers correct to 3 significant figures, or 1 decimal place for angles in degrees, unless a different level of accuracy is specified in the question.
- For π, use either your calculator value or 3.142.

INFORMATION

- The total mark for this paper is 56.
- The number of marks for each question or part question is shown in brackets [ ].

© UCLES 2024

1 Write the number 31 072 000 in words.

..... [1]

View solution

2

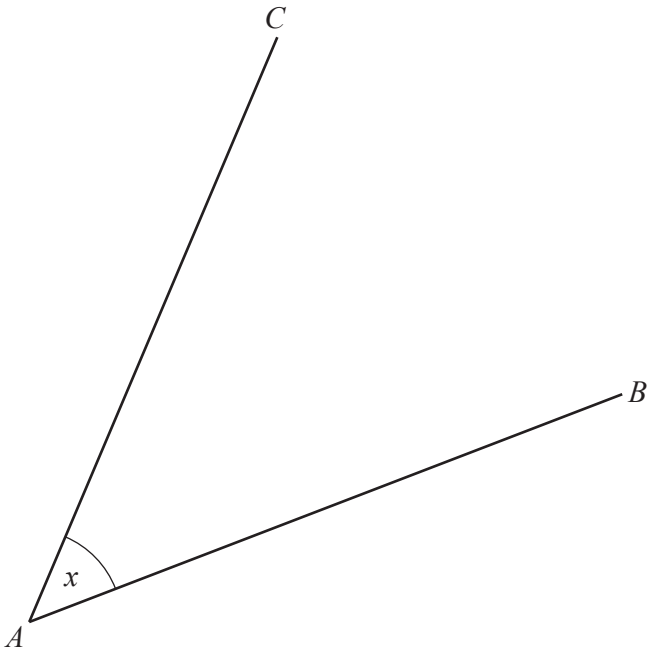

(a) Measure the size of angle x.

View solution

..... [1]

(b) Measure the length of line AB in millimetres.

View solution

..... mm [1]

(c) Mark the midpoint, M, of line AB. [1]

View solution

(d) Draw a line through the point M that is perpendicular to line AB. [1]

View solution

3 Find the value of the reciprocal of 0.4 .

View solution

..... [1]

4 Write these numbers in order, starting with the smallest.

View solution

$\frac{6}{7}$ $\quad 8.6\times10^{-1}$ $\quad \frac{11}{13}$ $\quad 86.5\%$

..... < ..... < ..... < ..... [2]

smallest

© UCLES 2024

5 **(a)**

View solution



Draw all the lines of symmetry on this quadrilateral. [2]

(b) Write down the mathematical name of a quadrilateral that has rotational symmetry of order 2.

View solution

..... [1]

6 The temperature at midnight is −4 °C.
The temperature at noon is 25 °C.

View solution

Work out the difference between these two temperatures.

..... °C [1]

7 A gardener charges \$6.55 for each hour he works plus a fixed charge of \$15.50 .

View solution

Calculate the total amount he charges when he works for 4 hours.

\$ ..... [2]

8 Jonah has \$750.
He spends $\frac{1}{4}$ of this money on travel, and some of this money on food.
He now has \$437.50 .

View solution

Work out the fraction of the \$750 he spends on food.

..... [3]

© UCLES 2024

9 A delivery driver records the number of pizzas she delivers each month for one year.

48	44	39	28	57	22
36	41	54	57	49	52

View solution

(a) Complete the stem-and-leaf diagram.

2	
3	
4	
5	

Key: 4 | 8 represents 48 pizzas

[2]

(b) Find the median.

View solution

..... [1]

10 $\mathbf{a} = \begin{pmatrix} 5 \\ -7 \end{pmatrix}$ $\mathbf{b} = \begin{pmatrix} 6 \\ -7 \end{pmatrix}$

View solution

Work out $\mathbf{a} - \mathbf{b}$.

$\begin{pmatrix} \quad \\ \quad \end{pmatrix}$ [1]

11 These are the first four terms of a sequence.

23 17 11 5

(a) Write down the next two terms.

View solution

..... , ... [2]

(b) Find the nth term.

View solution

..... [2]

© UCLES 2024

12 Write 0.04628 correct to 2 significant figures.

View solution

..... [1]

13

View solution

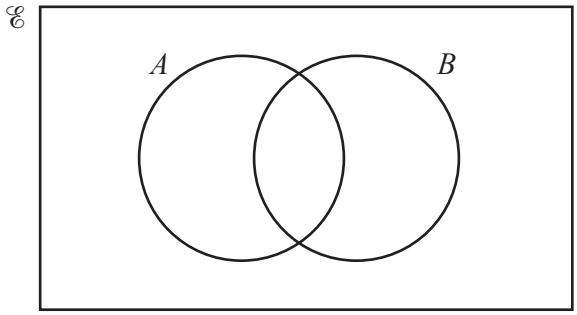

On the Venn diagram, shade the region $A \cup B$. [1]

14 Factorise completely.

$$20x - 90x^2$$

View solution

..... [2]

15 Describe the type of correlation between the speed of runners and the time taken to complete a race.

View solution

..... [1]

16 A circle has an area of $36\pi\,\text{cm}^2$.

(a) Find the circumference of the circle.
Give your answer in terms of π.

View solution

..... cm [3]

(b) The circle forms the base of a cylinder with height h cm.
The volume of the cylinder is $540\pi\,\text{cm}^3$.

View solution

Work out the value of h.

$h =$ ..... [2]

© UCLES 2024

17 Write 174 000 in standard form.

View solution

..... [1]

18

View solution

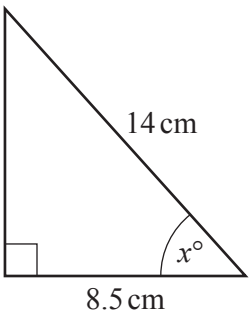

NOT TO SCALE

The diagram shows a right-angled triangle.

Calculate the value of x.

$x =$ ..... [2]

19 **Without using a calculator**, work out $2\frac{1}{4} \div 1\frac{7}{8}$.

View solution

You must show all your working and give your answer as a mixed number in its simplest form.

..... [3]

20 Expand and simplify.

$$(x-4)(x-7)$$

View solution

..... [2]

© UCLES 2024

21 $5^7 \div 5^x = 5^3$

View solution

Find the value of x.

$x =$ ..... [1]

View solution

22 The length, l metres, of a piece of material is 4.5 m, correct to the nearest 10 cm.

Complete this statement about the value of l.

..... $\leqslant l <$ ..... [2]

View solution

23 $\mathscr{E} = \{x: x \text{ is a natural number less than } 12\}$
$S = \{1, 4, 7, 10\}$
$T = \{1, 3, 5, 7, 9, 11\}$

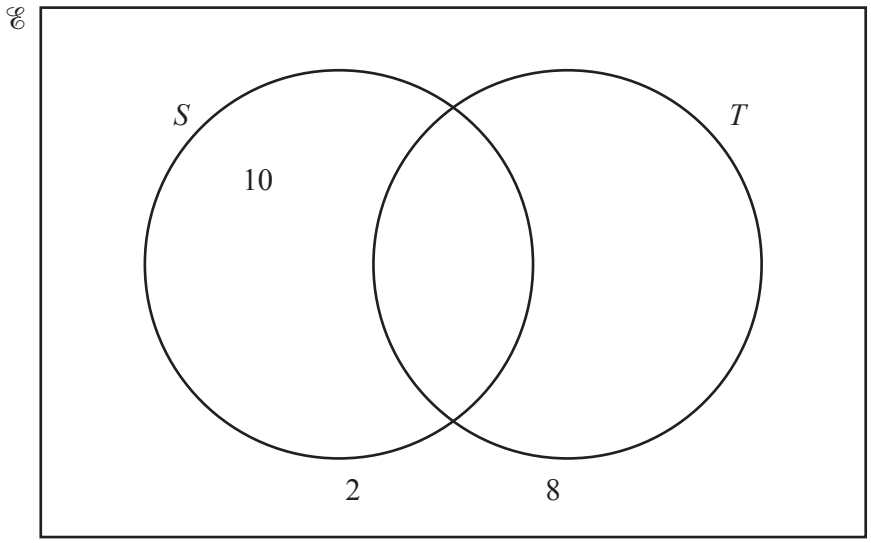

Complete the Venn diagram.

[2]

View solution

24 In a class of 30 students, 13 travel to school by bus.
There are 570 students in the school.

Find the expected number of students in the school who travel by bus.

..... [2]

Question 25 is printed on the next page.

© UCLES 2024

25

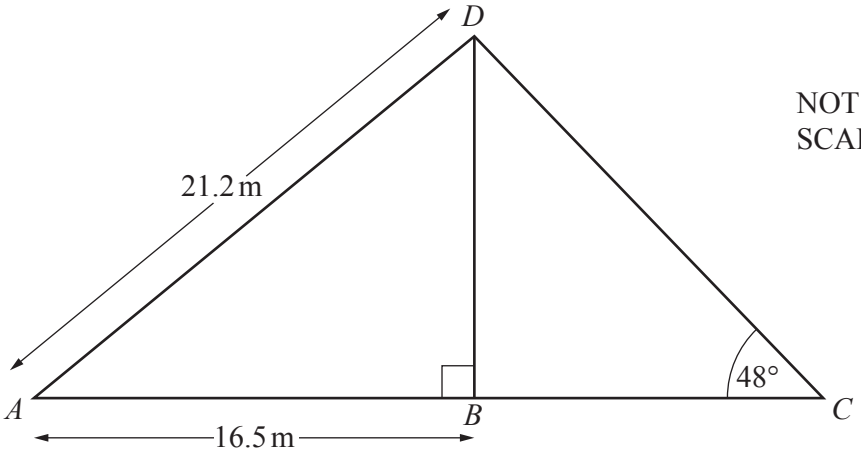

The diagram shows a flagpole, BD, held by two ropes, AD and CD.
ABC is a straight line and angle $ABD = 90°$.
$AD = 21.2$ m, $AB = 16.5$ m and angle $BCD = 48°$.

(a) Show that the height of the flagpole BD is 13.3 m, correct to 1 decimal place.

View solution

[3]

(b) Calculate the length of the rope CD.

View solution

$CD =$ ..... m [3]

Permission to reproduce items where third-party owned material protected by copyright is included has been sought and cleared where possible. Every reasonable effort has been made by the publisher (UCLES) to trace copyright holders, but if any items requiring clearance have unwittingly been included, the publisher will be pleased to make amends at the earliest possible opportunity.

To avoid the issue of disclosure of answer-related information to candidates, all copyright acknowledgements are reproduced online in the Cambridge Assessment International Education Copyright Acknowledgements Booklet. This is produced for each series of examinations and is freely available to download at www.cambridgeinternational.org after the live examination series.

Cambridge Assessment International Education is part of Cambridge Assessment. Cambridge Assessment is the brand name of the University of Cambridge Local Examinations Syndicate (UCLES), which is a department of the University of Cambridge.