Cambridge Assessment International Education

Cambridge IGCSE™

CANDIDATE NAME									
CENTRE NUMBER						CANDIDATE NUMBER				

MATHEMATICS **0580/21**

Paper 2 Non-calculator (Extended) **May/June 2025**

2 hours

You must answer on the question paper.

You will need: Geometrical instruments

INSTRUCTIONS
- Answer **all** questions.
- Use a black or dark blue pen. You may use an HB pencil for any diagrams or graphs.
- Write your name, centre number and candidate number in the boxes at the top of the page.
- Write your answer to each question in the space provided.
- Do **not** use an erasable pen or correction fluid.
- Do **not** write on any bar codes.
- Calculators must **not** be used in this paper.
- You may use tracing paper.
- You must show all necessary working clearly.

INFORMATION
- The total mark for this paper is 100.
- The number of marks for each question or part question is shown in brackets [ ].

This document has **20** pages. Any blank pages are indicated.

© UCLES 2025

List of formulas

Area, A, of triangle, base b, height h.	$A = \frac{1}{2}bh$
Area, A, of circle of radius r.	$A = \pi r^2$
Circumference, C, of circle of radius r.	$C = 2\pi r$
Curved surface area, A, of cylinder of radius r, height h.	$A = 2\pi rh$
Curved surface area, A, of cone of radius r, sloping edge l.	$A = \pi rl$
Surface area, A, of sphere of radius r.	$A = 4\pi r^2$
Volume, V, of prism, cross-sectional area A, length l.	$V = Al$
Volume, V, of pyramid, base area A, height h.	$V = \frac{1}{3}Ah$
Volume, V, of cylinder of radius r, height h.	$V = \pi r^2 h$
Volume, V, of cone of radius r, height h.	$V = \frac{1}{3}\pi r^2 h$
Volume, V, of sphere of radius r.	$V = \frac{4}{3}\pi r^3$
For the equation $ax^2 + bx + c = 0$, where $a \neq 0$,	$x = \frac{-b \pm \sqrt{b^2 - 4ac}}{2a}$

For the triangle shown,

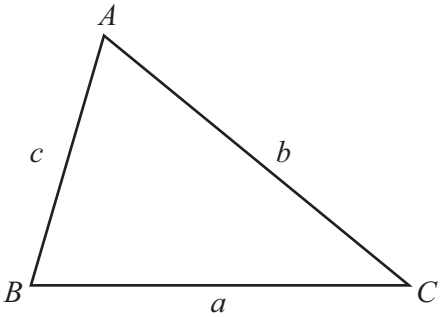

$$\frac{a}{\sin A} = \frac{b}{\sin B} = \frac{c}{\sin C}$$

$$a^2 = b^2 + c^2 - 2bc\cos A$$

$$\text{Area} = \frac{1}{2}ab\sin C$$

Calculators must **not** be used in this paper.

View solution

1 Simplify.

$7c - 5d + c + 3d$

..... [2]

View solution

2

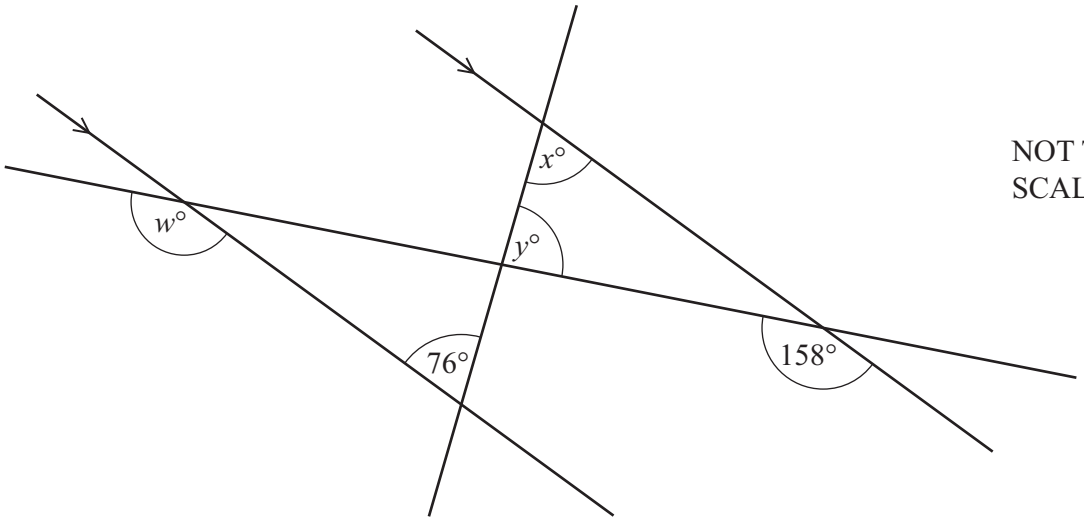

NOT TO SCALE

The diagram shows two parallel lines intersecting two straight lines.

Find the values of w, x and y.

$w =$ .....

$x =$ .....

$y =$ .....

[4]

3 Sally invests \$1500 at 3% per year simple interest.

Work out the total value of her investment at the end of 6 years.

View solution

\$ ..... [3]

4 Work out.

View solution

$$\frac{5}{6} - \frac{2}{3} \times \frac{3}{8}$$

..... [3]

5 The interior angle of a regular polygon is 150°.

View solution

Find the number of sides of this polygon.

..... [2]

6

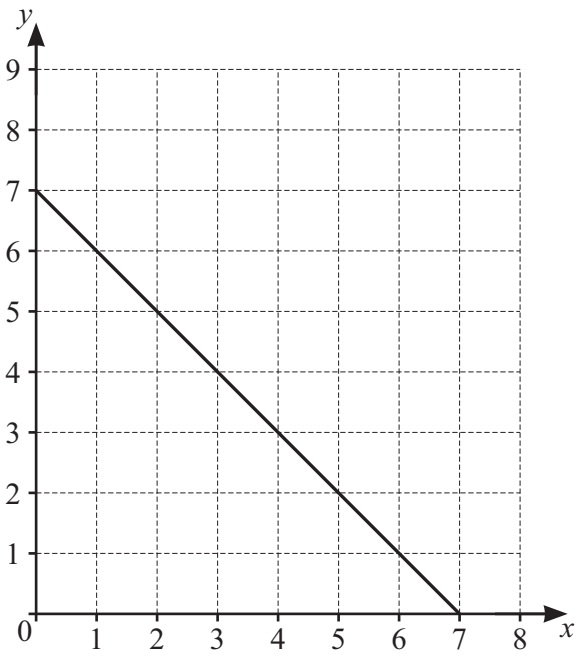

The line $x+y=7$ is drawn on the grid.

View solution

(a) On the grid, draw the line $y=2x+1$. [2]

View solution

(b) Use your graph to solve these simultaneous equations.

$$x+y=7$$
$$y=2x+1$$

$x=$ .....

$y=$ ..... [1]

View solution

7 Write the recurring decimal $0.2\dot{6}$ as a fraction.
Give your answer in its simplest form.

..... [3]

8 $\mathbf{m} = \begin{pmatrix} 11 \\ 5 \end{pmatrix}$ $\mathbf{n} = \begin{pmatrix} 8 \\ -3 \end{pmatrix}$

View solution

(a) Find $2\mathbf{m} - \mathbf{n}$.

( ) [2]

View solution

(b) The vector $\begin{pmatrix} 5 \\ \sqrt{y} \end{pmatrix}$ has a magnitude of 7.

Find the value of y.

$y =$ ..... [2]

View solution

9 The table shows some information about the marks scored by a group of students in a test.

Test mark	4	5	8
Frequency	2	4	n

The mean mark is 6.

Work out the value of n.

$n =$ ..... [3]

© UCLES 2025

10

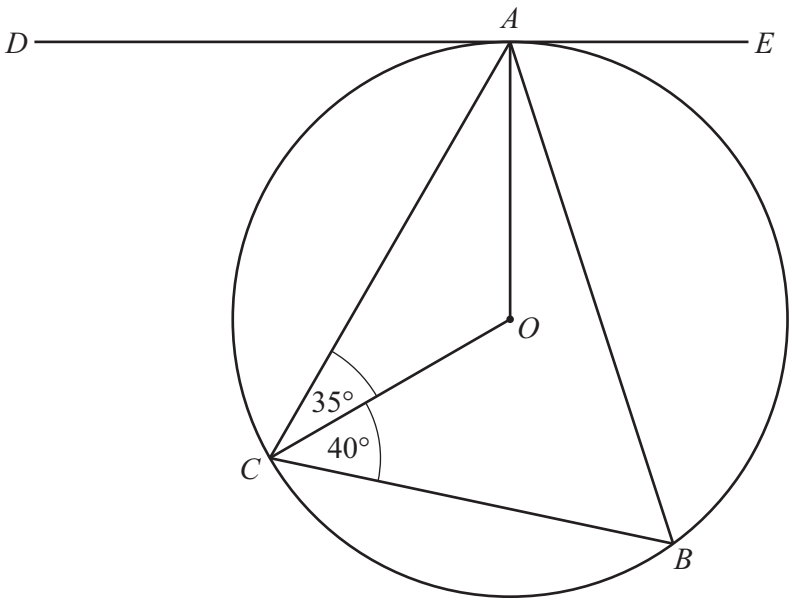

NOT TO SCALE

A, B and C are three points on a circle, centre O.
DE is a tangent to the circle at A.
Angle $ACO = 35°$ and angle $BCO = 40°$.

Find

(a) angle AOC

View solution

Angle AOC = ... [1]

(b) angle ABC

View solution

Angle ABC = ... [1]

(c) angle DAC

View solution

Angle DAC = ... [1]

(d) angle OAB.

View solution

Angle OAB = ... [1]

© UCLES 2025

11 The diagram shows the graph of $y = f(x)$ and the point $P(-2, 11)$.

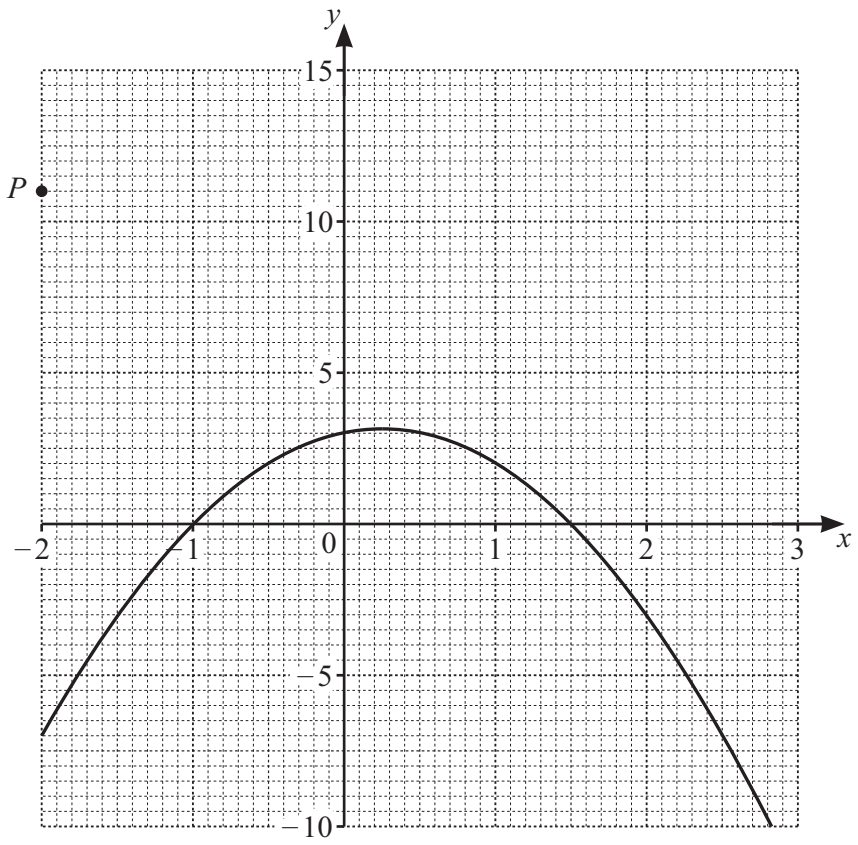

The tangent from P touches the graph of $y = f(x)$ at the point (a, b).
The values of a and b are integers.

(a) By drawing this tangent, find the value of a and the value of b.

View solution

$a =$ ....., $b =$ ..... [2]

(b) Find the equation of the tangent.
Give your answer in the form $y = mx + c$.

View solution

$y =$ ..... [3]

12 The time spent on the internet by each of 120 adults is recorded for one day.
The cumulative frequency diagram shows this information.

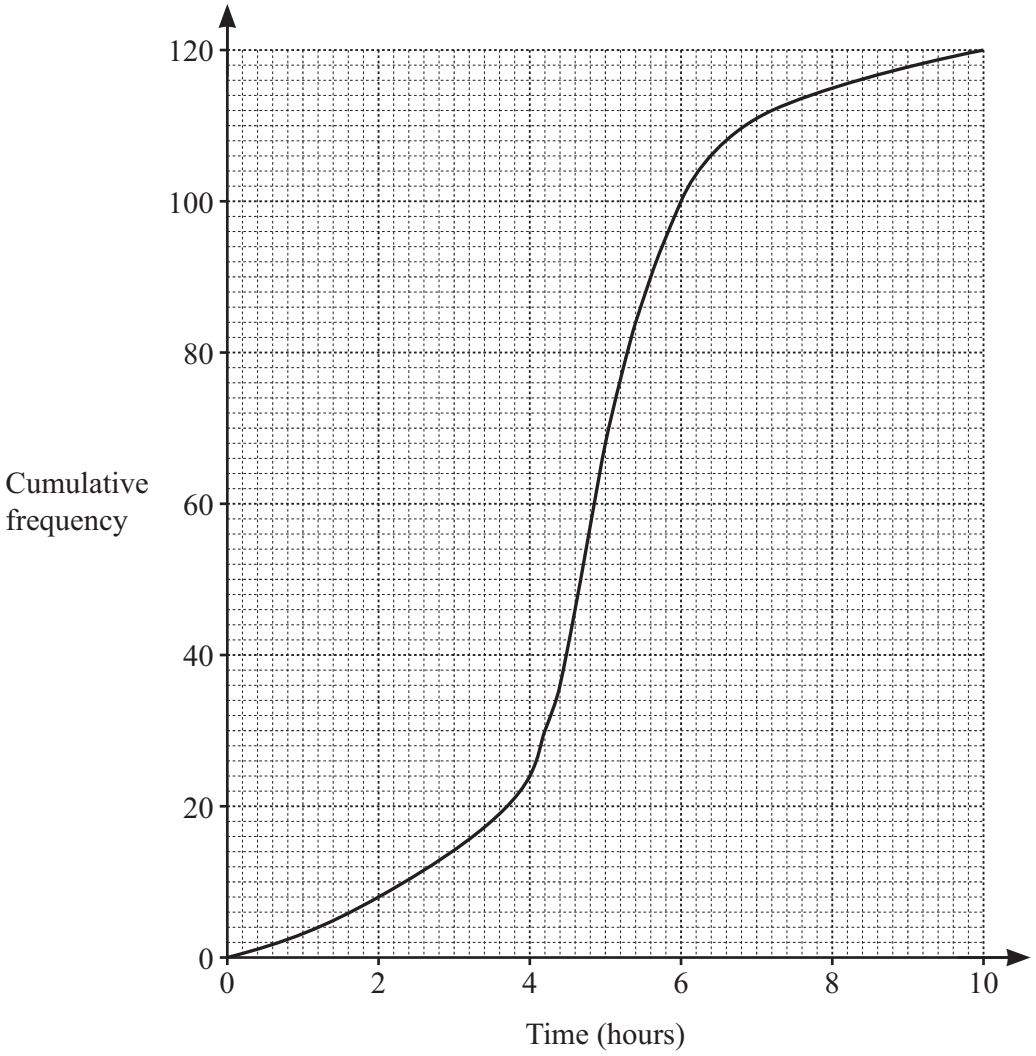

(a) Use the cumulative frequency diagram to find an estimate of the interquartile range.

View solution

..... h [2]

(b) 70% of the adults spent less than k hours on the internet.

Use the cumulative frequency diagram to find an estimate of the value of k.

View solution

$k =$ ..... [2]

13

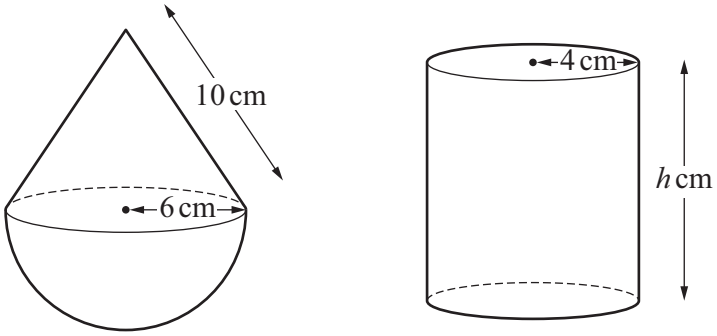

NOT TO SCALE

Solid *A* Solid *B*

The diagram shows solid *A* and solid *B*.
Solid *A* is made from a hemisphere and a cone each with radius 6 cm.
The cone has sloping edge 10 cm.
Solid *B* is a cylinder with radius 4 cm and height *h* cm.

The **total** surface area of solid *A* is equal to the **total** surface area of solid *B*.

(a) Work out the value of *h*.

View solution

h = ... [5]

(b) Work out the height of solid *A*.

View solution

..... cm [3]

© UCLES 2025

14 $f(x) = 3x - 4$ $g(x) = 4x + 1$

(a) Find $f(-2)$.

View solution

..... [1]

(b) Find $f^{-1}(x)$.

View solution

$f^{-1}(x) =$ ..... [2]

(c) $fg(x) = ax + b$

View solution

Find the value of a, and the value of b.

$a =$ ..... $b =$ ..... [2]

(d) Simplify.

View solution

$$\frac{2}{f(x)} - \frac{5}{g(x)}$$

Give your answer as a single fraction in terms of x.

..... [3]

© UCLES 2025

15 **(a)** Expand and simplify.

View solution

$$(2-\sqrt{5})(1-3\sqrt{5})$$

..... [2]

(b) Rationalise the denominator.
Give your answer in its simplest form.

View solution

$$\frac{6}{\sqrt{10}}$$

..... [2]

16 Expand and simplify.

View solution

$$(x+4)(x-3)(3x+2)$$

..... [3]

© UCLES 2025

17 **(a)** A bag contains 6 red marbles, 3 green marbles and 1 blue marble.
Two marbles are picked at random from the bag **with replacement**.

View solution

Find the probability that both marbles are green.

..... [2]

(b) Another bag contains 4 red counters and 2 yellow counters.
Two counters are picked at random from this bag **without replacement**.

View solution

(i) Complete the tree diagram.

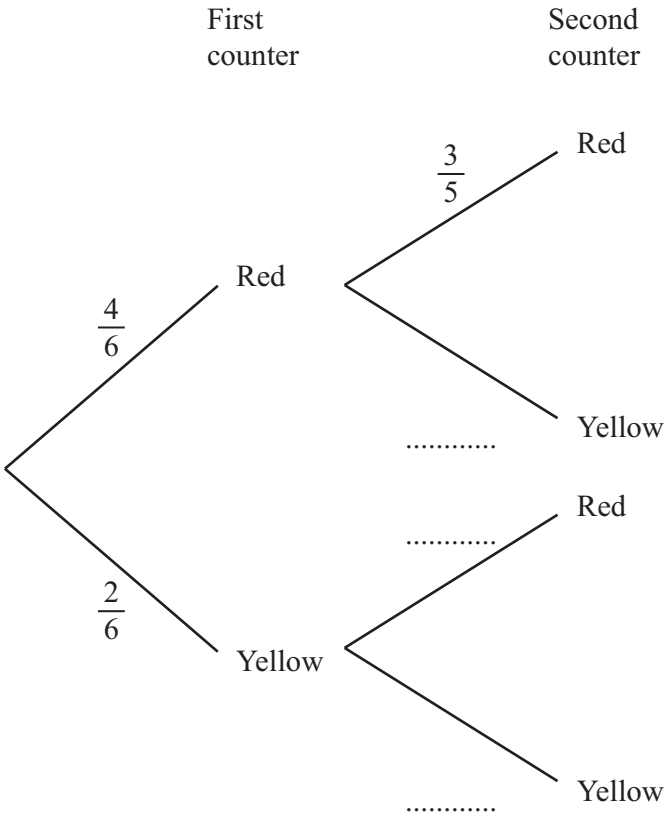

[2]

(ii) Find the probability that one of the two counters is yellow.

View solution

..... [3]

18 One day, Anya runs 12 km at a speed of x km/h.
The next day she walks 10 km at a speed of $(x-4)$ km/h.

(a) Write down an expression, in terms of x, for the time she spends running.

View solution

..... h [1]

(b) Write down an expression, in terms of x, for the time she spends walking.

View solution

..... h [1]

(c) The time Anya spends walking is 1 hour more than the time she spends running.

Write an equation in terms of x and show that it simplifies to $x^2 - 2x - 48 = 0$.

View solution

[4]

(d) Use factorisation to solve the equation $x^2 - 2x - 48 = 0$.

View solution

$x =$ ..... or $x =$ ..... [3]

(e) Find the time Anya spends running.

View solution

..... h [1]

© UCLES 2025

19 Find the value of $27^{-\frac{2}{3}}$.

View solution

..... [2]

20

View solution

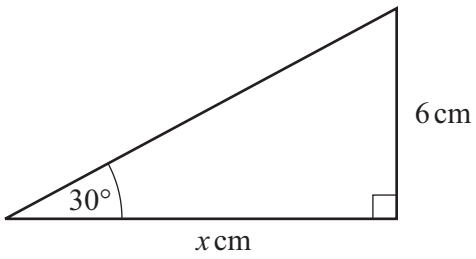

NOT TO SCALE

Find the exact value of x.

$x =$ ..... [4]

© UCLES 2025

21

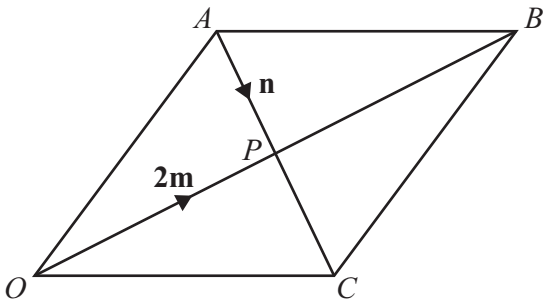

NOT TO SCALE

$OABC$ is a rhombus and O is the origin.
The diagonals of the rhombus intersect at P.
$\overrightarrow{OP} = 2\,\mathbf{m}$ and $\overrightarrow{AP} = \mathbf{n}$.

(a) Find, in terms of **m** and **n**, in its simplest form

(i) $\overrightarrow{OA}$

View solution

$\overrightarrow{OA} =$ ..... [1]

(ii) $\overrightarrow{OC}$.

View solution

$\overrightarrow{OC} =$ ..... [1]

(b) D is the point such that $\overrightarrow{AD} = 10\mathbf{m} - 3\mathbf{n}$.

View solution

Show that $OADC$ is a trapezium.

[3]

© UCLES 2025

22 A curve has equation $y = x^n + qx^2 + 9x$.

$$\frac{dy}{dx} = 3x^2 - 12x + 9$$

(a) Find the value of n, and the value of q.

View solution

$n =$ ..... $q =$ ..... [2]

(b) Work out the coordinates of the turning points of the curve.

View solution

(..... , ...) and (..... , ...) [4]

© UCLES 2025

23 Simplify.

View solution

$$\frac{2x^2 + 10x}{x^2 - 25}$$

..... [3]

BLANK PAGE

BLANK PAGE

Permission to reproduce items where third-party owned material protected by copyright is included has been sought and cleared where possible. Every reasonable effort has been made by the publisher (UCLES) to trace copyright holders, but if any items requiring clearance have unwittingly been included, the publisher will be pleased to make amends at the earliest possible opportunity.

To avoid the issue of disclosure of answer-related information to candidates, all copyright acknowledgements are reproduced online in the Cambridge Assessment International Education Copyright Acknowledgements Booklet. This is produced for each series of examinations and is freely available to download at www.cambridgeinternational.org after the live examination series.

Cambridge Assessment International Education is part of Cambridge Assessment. Cambridge Assessment is the brand name of the University of Cambridge Local Examinations Syndicate (UCLES), which is a department of the University of Cambridge.

© UCLES 2025