CAMBRIDGE
International Education

Cambridge IGCSE™

CANDIDATE NAME									
CENTRE NUMBER						CANDIDATE NUMBER				

MATHEMATICS **0580/13**

Paper 1 Non-calculator (Core) **May/June 2026**

1 hour 30 minutes

You must answer on the question paper.

You will need: Geometrical instruments

INSTRUCTIONS
- Answer **all** questions.
- Use a black or dark blue pen. You may use an HB pencil for any diagrams or graphs.
- Write your name, centre number and candidate number in the boxes at the top of the page.
- Write your answer to each question in the space provided.
- Do **not** use an erasable pen. Do **not** use correction fluid or tape.
- Do **not** write on any bar codes.
- Calculators must not be used in this paper.
- You may use tracing paper.
- You must show all necessary working clearly.

INFORMATION
- The total mark for this paper is 80.
- The number of marks for each question or part question is shown in brackets [ ].

This document has **16** pages.

© Cambridge University Press & Assessment 2026

List of formulas

Area, A, of triangle, base b, height h.	$A = \frac{1}{2}bh$
Area, A, of circle of radius r.	$A = \pi r^2$
Circumference, C, of circle of radius r.	$C = 2\pi r$
Curved surface area, A, of cylinder of radius r, height h.	$A = 2\pi rh$
Curved surface area, A, of cone of radius r, sloping edge l.	$A = \pi rl$
Surface area, A, of sphere of radius r.	$A = 4\pi r^2$
Volume, V, of prism, cross-sectional area A, length l.	$V = Al$
Volume, V, of pyramid, base area A, height h.	$V = \frac{1}{3}Ah$
Volume, V, of cylinder of radius r, height h.	$V = \pi r^2 h$
Volume, V, of cone of radius r, height h.	$V = \frac{1}{3}\pi r^2 h$
Volume, V, of sphere of radius r.	$V = \frac{4}{3}\pi r^3$

© Cambridge University Press & Assessment 2026

Calculators must **not** be used in this paper.

1 Write down the number that is 1 more than 4 999 499.

View solution

..... [1]

2 Write the number 707 700 in words.

View solution

.....

..... [1]

3

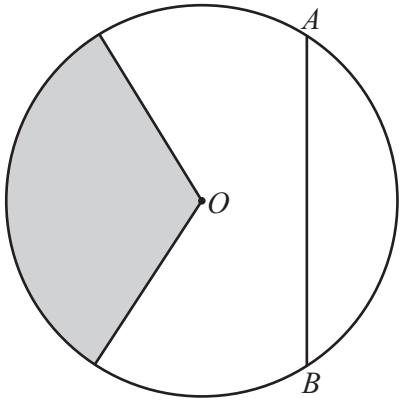

A and *B* are points on the circumference of a circle, centre *O*.

Write down the mathematical name for

(a) the line *AB*

View solution

..... [1]

(b) the shaded region.

View solution

..... [1]

© Cambridge University Press & Assessment 2026

4 A car hire company uses this formula to work out the hire cost, in dollars.

View solution

cost = fixed charge + rate per day × number of days

Find the cost of hiring a car for 7 days when the fixed charge is $140 and the rate per day is $30.

$ ..... [2]

5 Sam takes 75 minutes to make a cake.

The time taken to make the cake is in the ratio preparing : cooking : decorating = 6 : 10 : 9.

View solution

(a) Work out the number of minutes Sam takes to decorate the cake.

..... min [2]

View solution

(b) Sam starts making the cake at 12 42.

Find the time Sam finishes making the cake.

..... [1]

© Cambridge University Press & Assessment 2026

6 A book has 420 pages.

Meg reads 14 pages each day.

Meg has read $\frac{1}{3}$ of the number of pages so far.

Find how many days it will take Meg to finish reading the rest of the book.

View solution

..... [3]

7 Raj records the temperature, in °C, at midday for each of 8 days.
These are the results.

1, 10, 8, –3, –2, 10, 7, 9

(a) Calculate the mean.

View solution

..... °C [2]

(b) Find the median.

View solution

..... °C [2]

(c) When another temperature is recorded, the range increases by 5.

Find the two possible values of this temperature.

View solution

.....°C or .....°C [2]

© Cambridge University Press & Assessment 2026

8 Ben asks some children to choose their favourite type of snack.
The pie chart shows the results.

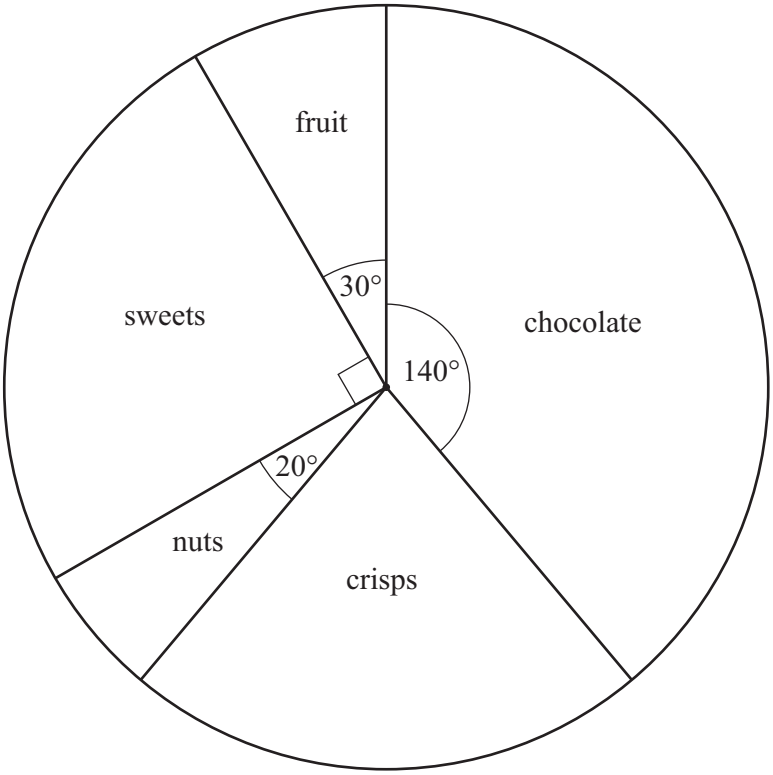

(a) Measure the sector angle for crisps.

View solution

..... [1]

(b) Find the fraction of the children who chose chocolate.
Give your answer in its simplest form.

View solution

..... [2]

(c) 8 more children chose fruit than those who chose nuts.

Work out the number of children who chose fruit.

View solution

..... [2]

© Cambridge University Press & Assessment 2026

9

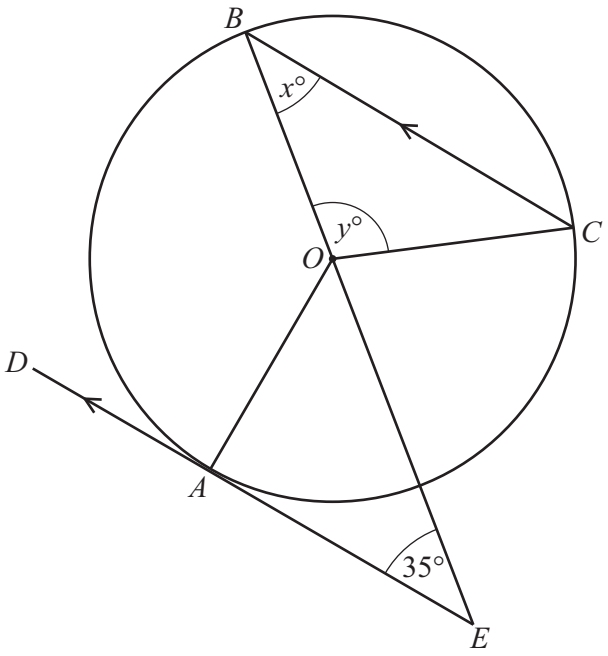

NOT TO SCALE

A, B and C are points on the circumference of the circle, centre O.

DAE is a tangent to the circle at A.
DE is parallel to BC.
BOE is a straight line.

(a) Write down the two geometrical reasons to explain why angle $AOE = 55°$.

View solution

1 .....

2 .....

[2]

(b) Find the value of x.

View solution

$x =$ ..... [1]

(c) Find the value of y.

View solution

$y =$ ..... [2]

© Cambridge University Press & Assessment 2026

10 $K = 2x + \sqrt{y}$

View solution

Find the value of K when $x = 5$ and $y = 169$.

$K =$ ..... [2]

11 $\frac{2}{5}$ of the area of a shape is blue, $\frac{3}{7}$ is green and the rest is red.

(a) What fraction of the shape is red?

View solution

..... [3]

(b) $12\,\text{cm}^2$ of the shape is green.

View solution

Find the total area of the shape.

..... cm^2 [2]

12 Factorise.

View solution

$5c - 15c^2d$

..... [2]

© Cambridge University Press & Assessment 2026

13 **(a)** Complete the table of values for $y = 6x - x^2 - 4$.

View solution

x	0	1	2	3	4	5	6
y				5	4	1	–4

[2]

View solution

(b) On the grid, draw the graph of $y = 6x - x^2 - 4$ for $0 \leqslant x \leqslant 6$.

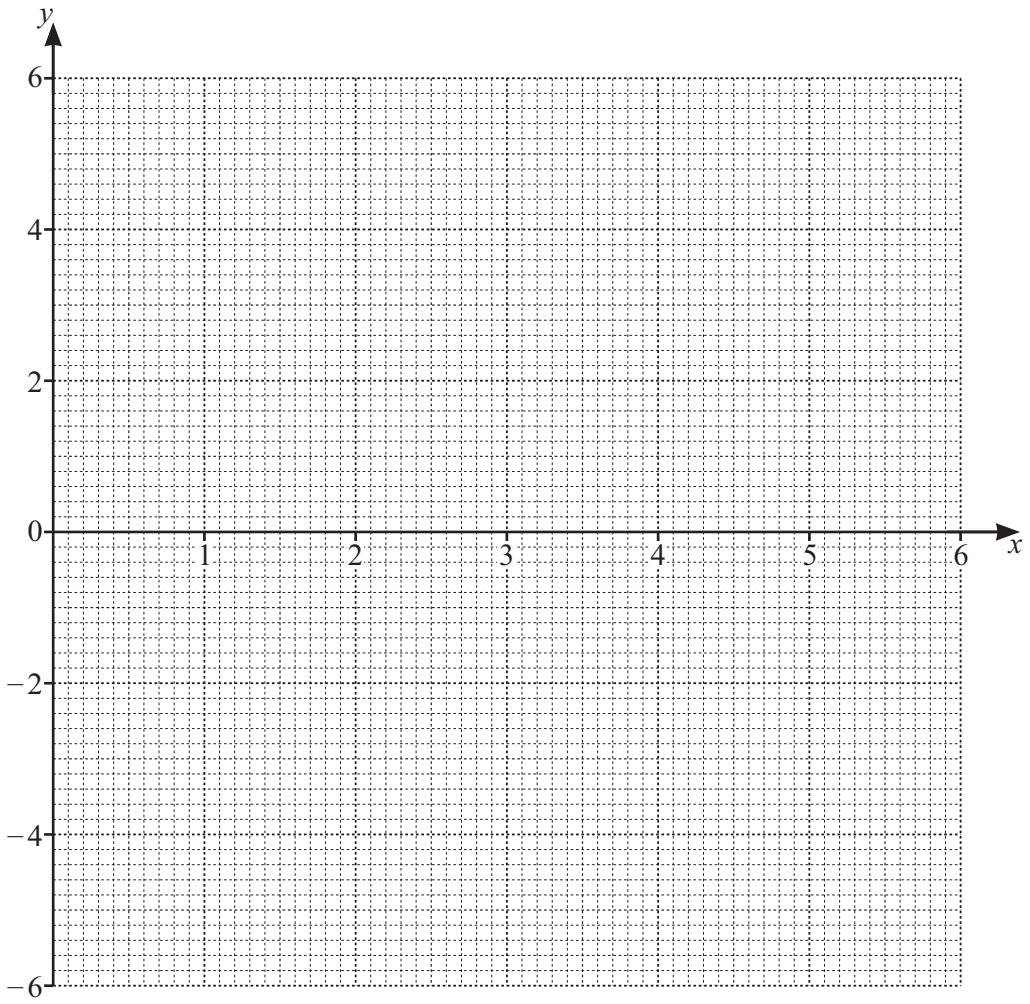

[4]

View solution

(c) On the grid, draw the line $y = 3$. [1]

View solution

(d) Use your graph to solve $6x - x^2 - 4 = 3$.

$x =$ ..... or $x =$ ..... [2]

© Cambridge University Press & Assessment 2026

14 (a) The diagram shows a right-angled triangular prism.

View solution

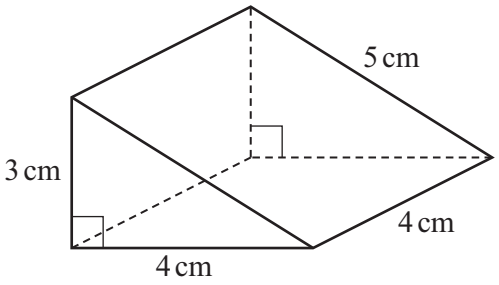

NOT TO SCALE

On the 1 cm^2 grid, complete the net of this prism.
One face has been drawn for you.

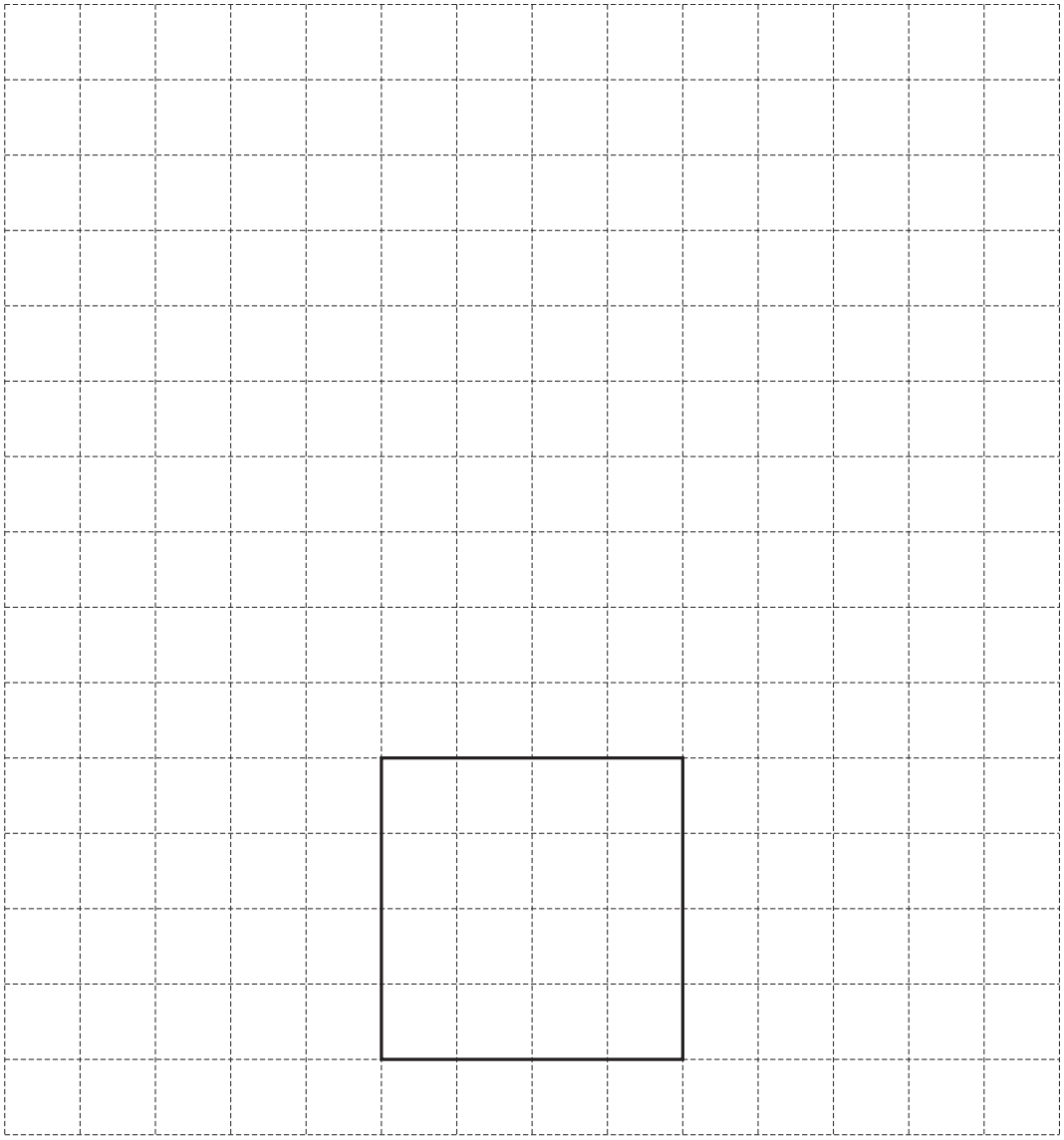

[3]

© Cambridge University Press & Assessment 2026

(b) Find the volume of the triangular prism.

View solution

..... cm^3 [2]

View solution

15 **(a)** In a restaurant the cost of a pizza is \$25.
The restaurant reduces the cost of the pizza to \$19.

Work out the percentage decrease in the cost.

..... % [2]

View solution

(b) In another restaurant, the cost of a pizza is \$15.
This restaurant adds a service charge of 10% to each pizza.

Find the cost of a pizza, including the service charge.

\$ ..... [2]

© Cambridge University Press & Assessment 2026

16 The area of a circle is $36\pi\,\text{cm}^2$.

Find the radius of the circle.

View solution

..... cm [2]

17 Convert $850\,\text{cm}^3$ into litres.

View solution

..... litres [1]

18 **(a)** Write down the value of $\sqrt[3]{27}$.

View solution

..... [1]

(b) Write 5^{-1} as a decimal.

View solution

..... [2]

© Cambridge University Press & Assessment 2026

19 **(a)** Write 84 as a product of its prime factors.

View solution

..... [2]

(b) 96 can be written as $2^P \times 3$.

View solution

Find the value of P.

$P =$ ..... [1]

(c) Use your answers to **19(a)** and **19(b)** to find the lowest common multiple (LCM) of 84 and 96. Leave your answer as a product of prime numbers.

View solution

..... [1]

© Cambridge University Press & Assessment 2026

20

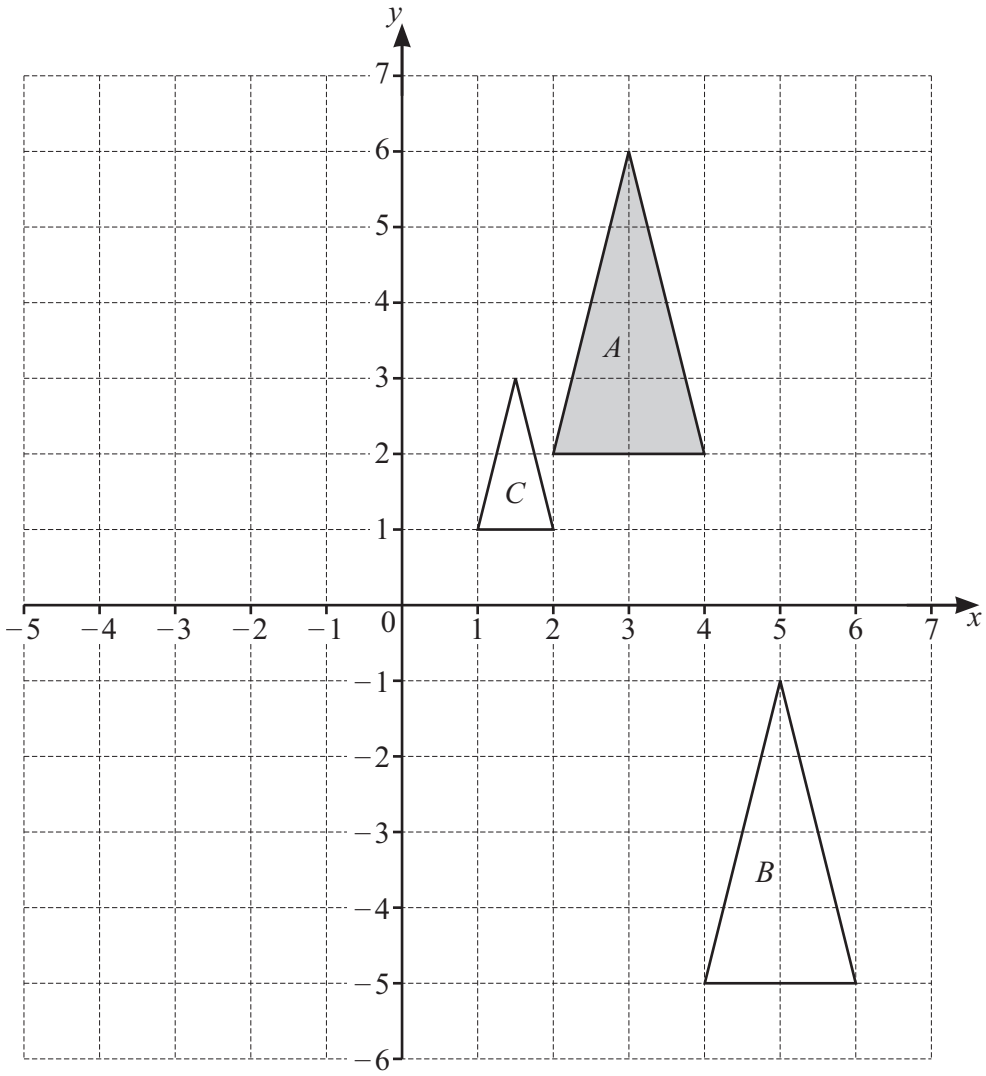

(a) Describe fully the **single** transformation that maps triangle *A* onto triangle *B*.

View solution

.....

..... [2]

(b) Describe fully the **single** transformation that maps triangle *A* onto triangle *C*.

View solution

.....

..... [3]

(c) On the grid, draw the image of shape *A* after a rotation 180°, centre (0, 0). [2]

View solution

© Cambridge University Press & Assessment 2026

21 By writing each number in the calculation correct to 1 significant figure, find an estimate for the value of

$$\frac{341 \times 0.47}{9.8}.$$

View solution

..... [2]

22 In this question, all lengths are in centimetres.

View solution

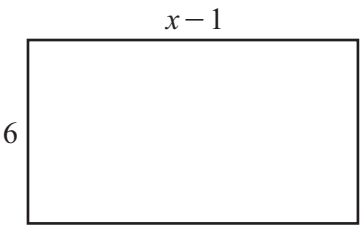

NOT TO SCALE

The area, in cm^2, of the rectangle is $5x + 8$.

Write an equation to show this information and solve it to find the value of x.

$x =$ ..... [3]

Question 23 is on the back page.

© Cambridge University Press & Assessment 2026

23 Solve the simultaneous equations.

View solution

$$x + 5y = 9$$
$$4x + 6y = 1$$

$x =$ .....

$y =$ .....

[3]

Permission to reproduce items where third-party owned material protected by copyright is included has been sought and cleared where possible. Every reasonable effort has been made by the publisher (Cambridge University Press & Assessment) to trace copyright holders, but if any items requiring clearance have unwittingly been included, the publisher will be pleased to make amends at the earliest possible opportunity.

To avoid the issue of disclosure of answer-related information to candidates, all copyright acknowledgements are reproduced online in our Copyright Acknowledgements Booklet. This is produced for each series of examinations and is freely available to download at www.cambridgeinternational.org after the live examination series.

Cambridge International Education is the name of our awarding body and a part of Cambridge University Press & Assessment, which is a department of the University of Cambridge.

© Cambridge University Press & Assessment 2026