Cambridge IGCSE

Cambridge International Examinations
Cambridge International General Certificate of Secondary Education

CANDIDATE NAME	
CENTRE NUMBER	
CANDIDATE NUMBER	

MATHEMATICS **0580/32**

Paper 3 (Core) **October/November 2015**

2 hours

Candidates answer on the Question Paper.

Additional Materials: Electronic calculator
Tracing paper (optional)
Geometrical instruments

READ THESE INSTRUCTIONS FIRST

Write your Centre number, candidate number and name on all the work you hand in.
Write in dark blue or black pen.
You may use an HB pencil for any diagrams or graphs.
Do not use staples, paper clips, glue or correction fluid.
DO **NOT** WRITE IN ANY BARCODES.

Answer **all** questions.
If working is needed for any question it must be shown below that question.
Electronic calculators should be used.
If the degree of accuracy is not specified in the question, and if the answer is not exact, give the answer to three significant figures. Give answers in degrees to one decimal place.
For π, use either your calculator value or 3.142.

At the end of the examination, fasten all your work securely together.
The number of marks is given in brackets [ ] at the end of each question or part question.
The total of the marks for this paper is 104.

The syllabus is approved for use in England, Wales and Northern Ireland as a Cambridge International Level 1/Level 2 Certificate.

This document consists of **15** printed pages and **1** blank page.

© UCLES 2015

CAMBRIDGE International Examinations

1 **(a)** Write down in figures the number twenty one million.

View solution

Answer(a)..... [1]

(b) Write down the four factors of 21.

View solution

Answer(b)..... , ... , ... , ... [2]

(c) Write 21% as a fraction.

View solution

Answer(c)..... [1]

(d) Put brackets in this calculation to make it correct.

View solution

$$210 + 21 \div 2.1 + 21 = 10$$

[1]

(e) Write down the first two prime numbers after 21.

View solution

Answer(e) ..... and ..... [2]

(f) Fill in the missing number.

View solution

$$\frac{21}{210} = \frac{210}{\ldots\ldots}$$

[1]

(g) Calculate $21^2 - \sqrt{21}$.

View solution

Answer(g)..... [1]

(h) Work out $(\sqrt{21})^2$.

View solution

Answer(h)..... [1]

(i) Write down the value of 21^0.

View solution

Answer(i)..... [1]

(j) Write 0.0021 in standard form.

View solution

Answer(j)..... [1]

(k) Write down the lowest common multiple (LCM) of 21 and 15.

View solution

Answer(k)..... [2]

© UCLES 2015

2 Here are the first four diagrams in a sequence.

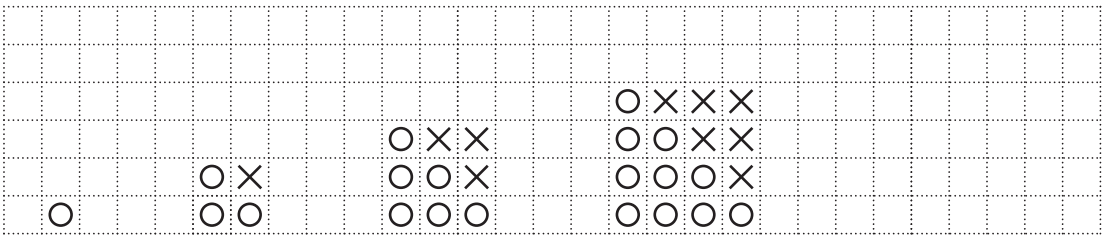

Diagram 1 Diagram 2 Diagram 3 Diagram 4 Diagram 5

View solution

(a) On the grid, draw Diagram 5. [1]

(b) Complete the table below for Diagram 4 and Diagram 5.

View solution

Diagram number	Number of Os	Number of Xs	Total number of Os and Xs
1	1	0	1
2	3	1	4
3	6	3	9
4			
5			

[2]

(c) Find an expression, in terms of *n,* for the total number of Os and Xs in Diagram *n*.

View solution

Answer(c)..... [1]

(d) Find the total number of Os and Xs in Diagram 23.

View solution

Answer(d)..... [1]

(e) Describe in words the rule for continuing the sequence for the number of Os.

View solution

1, 3, 6, …

Answer(e)..... [1]

© UCLES 2015

3 (a)

View solution

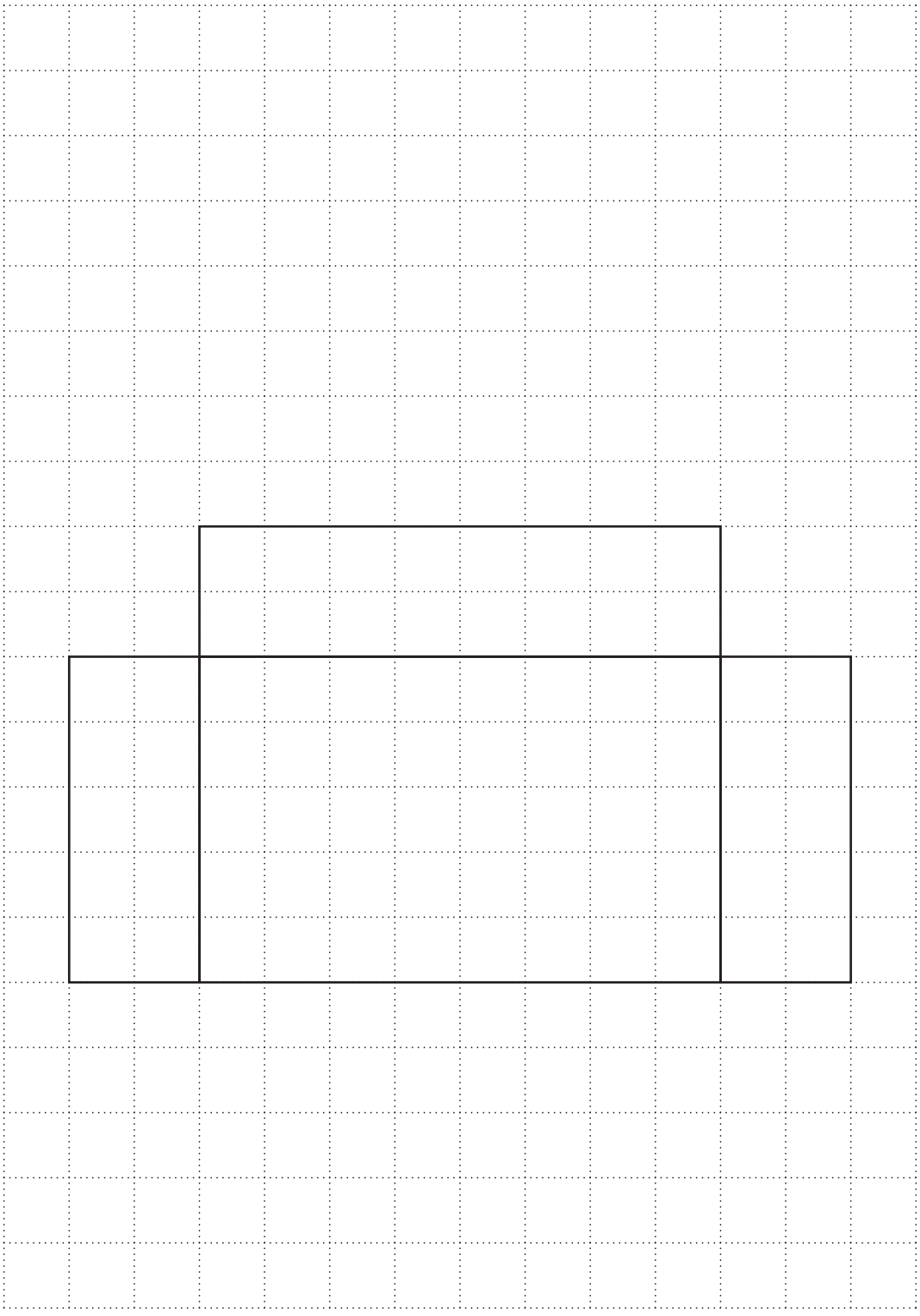

The diagram shows part of a net for a cuboid drawn on a 1 cm^2 grid.

(i) Complete the diagram for the net of the cuboid. [1]

(ii) Calculate the surface area of the cuboid.

View solution

Answer(a)(ii)..... cm^2 [2]

(iii) Calculate the volume of the cuboid.
Give the units of your answer.

View solution

Answer(a)(iii)..... ..... [3]

(b) A different cuboid has volume $60\,cm^3$.
Its sides are all integer lengths.
All of its sides have length greater than 1cm.
The length of one of its sides is a square number.

Write down the dimensions of the cuboid.

View solution

Answer(b) ..... cm by ..... cm by ..... cm [2]

4 (a)

View solution

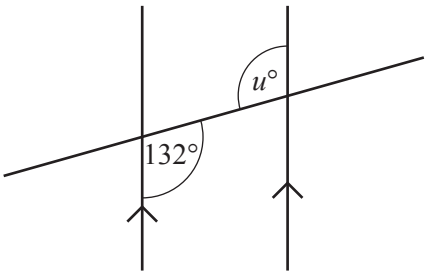

NOT TO SCALE

Find the value of u.

Answer(a) u = ... [1]

(b)

View solution

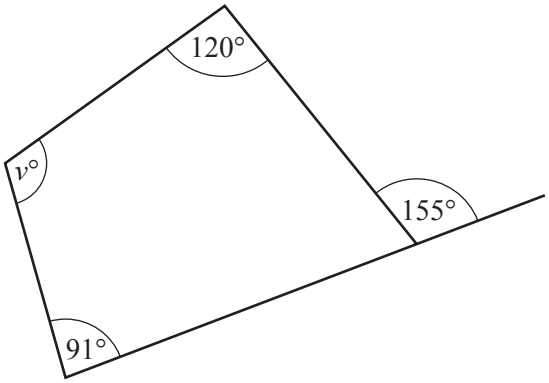

NOT TO SCALE

Find the value of v.

Answer(b) v = ... [2]

© UCLES 2015

(c)

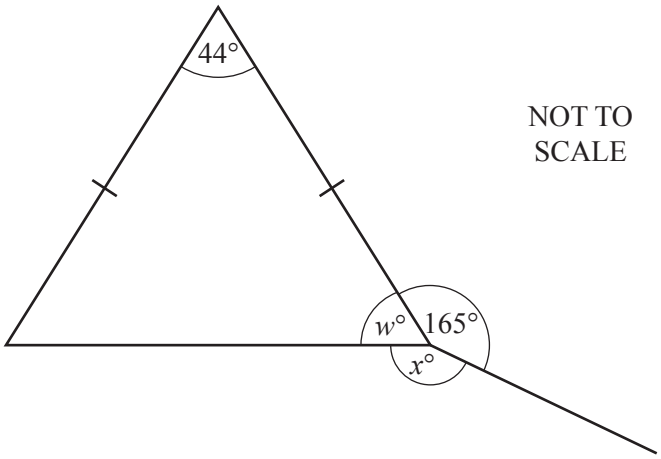

NOT TO SCALE

View solution

(i) Write down the mathematical name for this triangle.

Answer(c)(i) ..... [1]

(ii) Find the value of *w*.

View solution

Answer(c)(ii) *w* = ... [1]

(iii) Find the value of *x*.

View solution

Answer(c)(iii) *x* = ... [1]

(d)

View solution

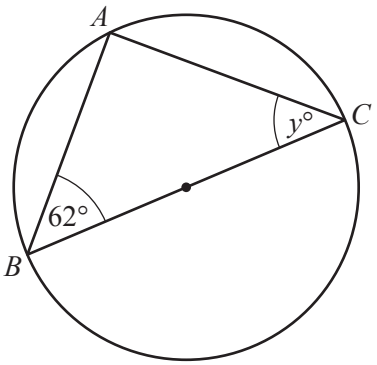

NOT TO SCALE

A, *B* and *C* lie on a circle with diameter *BC*.

(i) Find the value of *y*.

Answer(d)(i) *y* = ... [2]

(ii) Write down the mathematical name for the straight line *AB*.

View solution

Answer(d)(ii) ..... [1]

© UCLES 2015

5 **(a)** Some children are asked what their favourite sport is.
The results are shown in the pie chart.

View solution

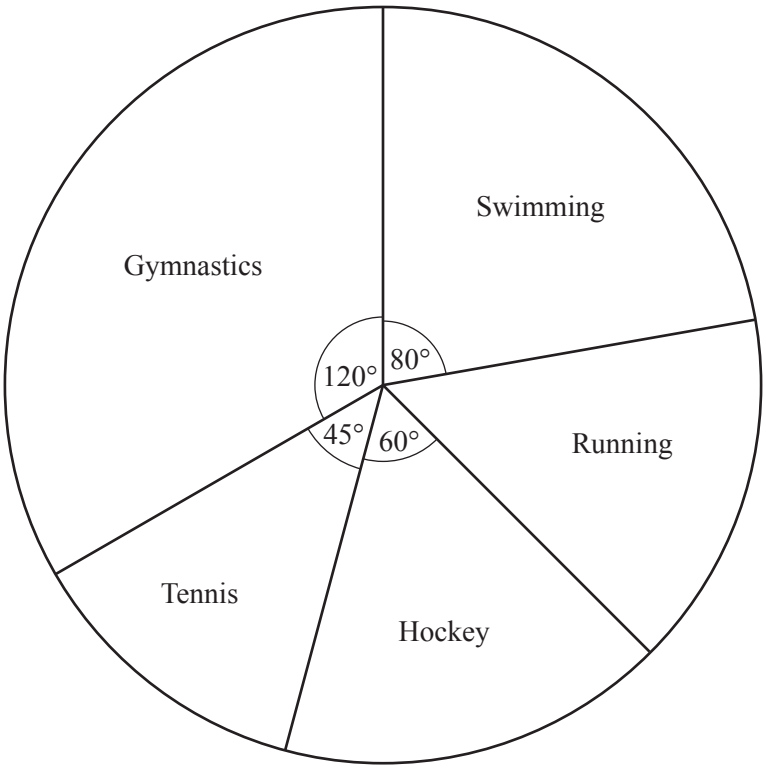

(i) Complete the statements about the pie chart.

The sector angle for running is ..... degrees.

The least popular sport is .....

$\frac{1}{6}$ of the children chose .....

Twice as many children chose ..... as ..... [4]

(ii) Five more children chose swimming than hockey.

View solution

Use this information to work out the number of children who chose gymnastics.

Answer(a)(ii)..... [3]

(b) Ten boys go swimming.
The teacher records, in seconds, the time each boy takes to

- get ready for swimming
- swim one length.

These times are shown in the table below.

Boy	A	B	C	D	E	F	G	H	I	J
Time to get ready	310	250	360	245	440	415	290	420	480	400
Time to swim one length	29	17	19	36	38	16	40	32	20	30

(i) A boy is chosen at random.

Find the probability that he takes more than 300 seconds to get ready.

Answer(b)(i)..... [1]

(ii) Complete the scatter diagram.
The first six points have been plotted for you.

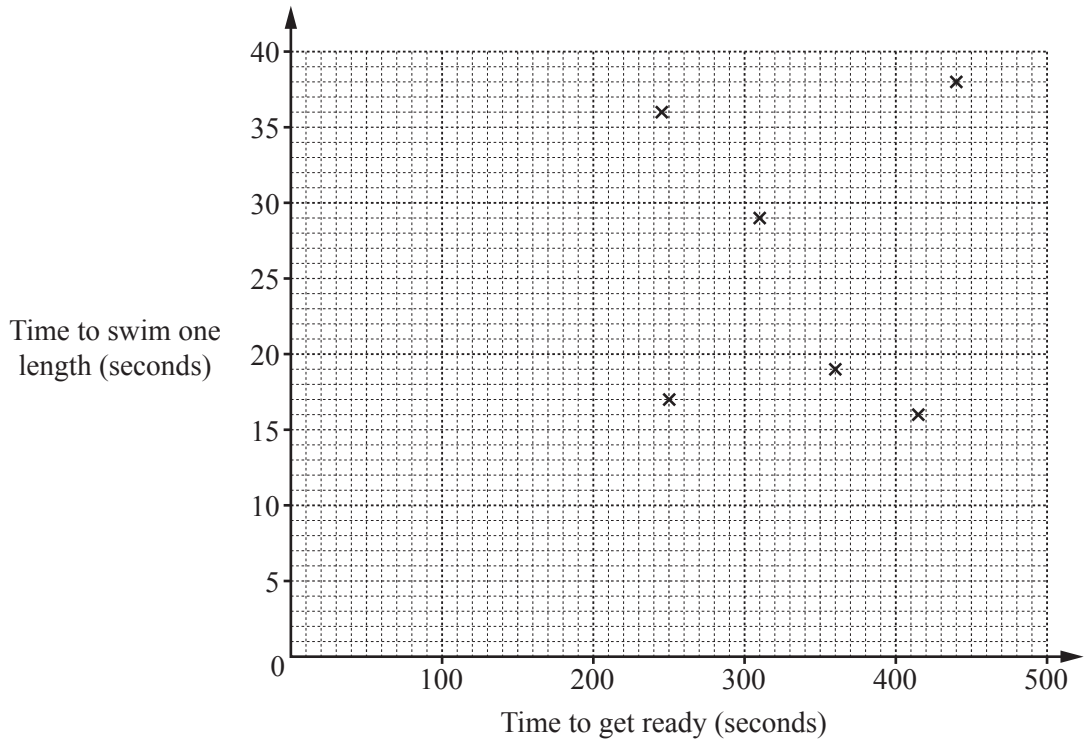

[2]

(iii) Another boy takes 340 seconds to get ready.

Can the scatter diagram be used to estimate the time it will take him to swim one length?
Give a reason for your answer.

Answer(b)(iii)..... because .....

..... [1]

6 A sweet shop sells lots of different types of sweets.

(a) **(i)** Each large bag of mixed sweets is divided in the ratio mints : jellies : toffees = 5 : 2 : 8.
Each large bag has a total of 180 sweets.

View solution

Calculate the number of sweets of each type in a large bag.

Answer(a)(i) Mints = ...

Jellies = ...

Toffees = ...[3]

(ii) The mass, m grams, of a small bag of sweets is 75 g, correct to the nearest gram.

View solution

Complete the statement about the value of m.

Answer(a)(ii)…… $\leqslant m <$ …….. [2]

(b) There are 156 g of sugar in a 240 g bar of chocolate.

View solution

(i) Write 156 as a percentage of 240.

Answer(b)(i) ..... % [1]

(ii) Work out the number of grams of sugar in a 1.2 **kilogram** bar of chocolate.

View solution

Answer(b)(ii) ..... g [2]

(iii) Another bar of chocolate is made.
The mass is 35% greater than the 240 g bar.

View solution

Work out the mass of this chocolate bar.

Answer(b)(iii) ..... g [2]

© UCLES 2015

(c) A girl buys a large piece of fudge.
She eats $\frac{3}{10}$ herself and divides the rest equally between 4 friends.

View solution

Work out the fraction of this fudge that each friend receives.

Answer(c) ..... [2]

(d) Gabriella and Max buy some bags of mints and some bags of toffees from the shop.
The cost of one bag of mints is m **cents** and the cost of one bag of toffees is t **cents**.

View solution

(i) Gabriella buys 3 bags of mints and 5 bags of toffees for \$4.70 .

Complete the equation.

$3m + 5t =$ ..... [1]

(ii) Max buys 4 bags of mints and 3 bags of toffees for \$3.70 .

View solution

Write this information as an equation.

Answer(d)(ii) ..... = ... [2]

(iii) Solve your two equations to find the cost of a bag of mints and the cost of a bag of toffees.
You must show all your working.

View solution

Answer(d)(iii) Cost of a bag of mints = ... cents

Cost of a bag of toffees = ... cents [4]

© UCLES 2015

7

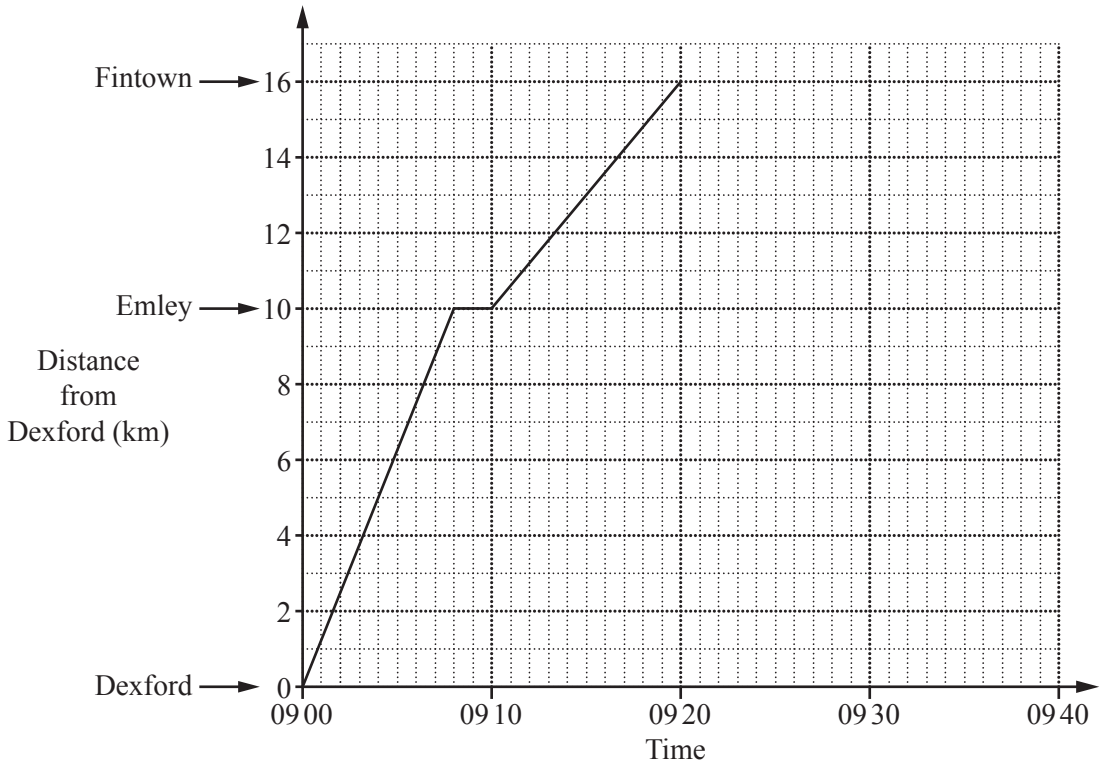

The grid shows the travel graph for a train travelling from Dexford to Fintown, stopping at Emley.

(a) **(i)** Write down the distance the train travels in the first 8 minutes.

View solution

Answer(a)(i)..... km [1]

(ii) Calculate the average speed, in kilometres per hour, for the journey from Dexford to Fintown.

View solution

Answer(a)(ii)..... km/h [3]

(b) The train waits at Fintown for 4 minutes.
The train then returns to Dexford without stopping at Emley.
The return speed of the train is 80 km/h.

View solution

(i) Complete the travel graph. [2]

(ii) Change 80 km/h to metres per second.

View solution

Answer(b)(ii)..... m/s [2]

(c) Trains leave Dexford for Fintown every 75 minutes.
The train that leaves Dexford at 09 00 is the first train of the day.

View solution

Write down the time that the fourth train leaves Dexford for Fintown.

Answer(c)..... [2]

© UCLES 2015

8

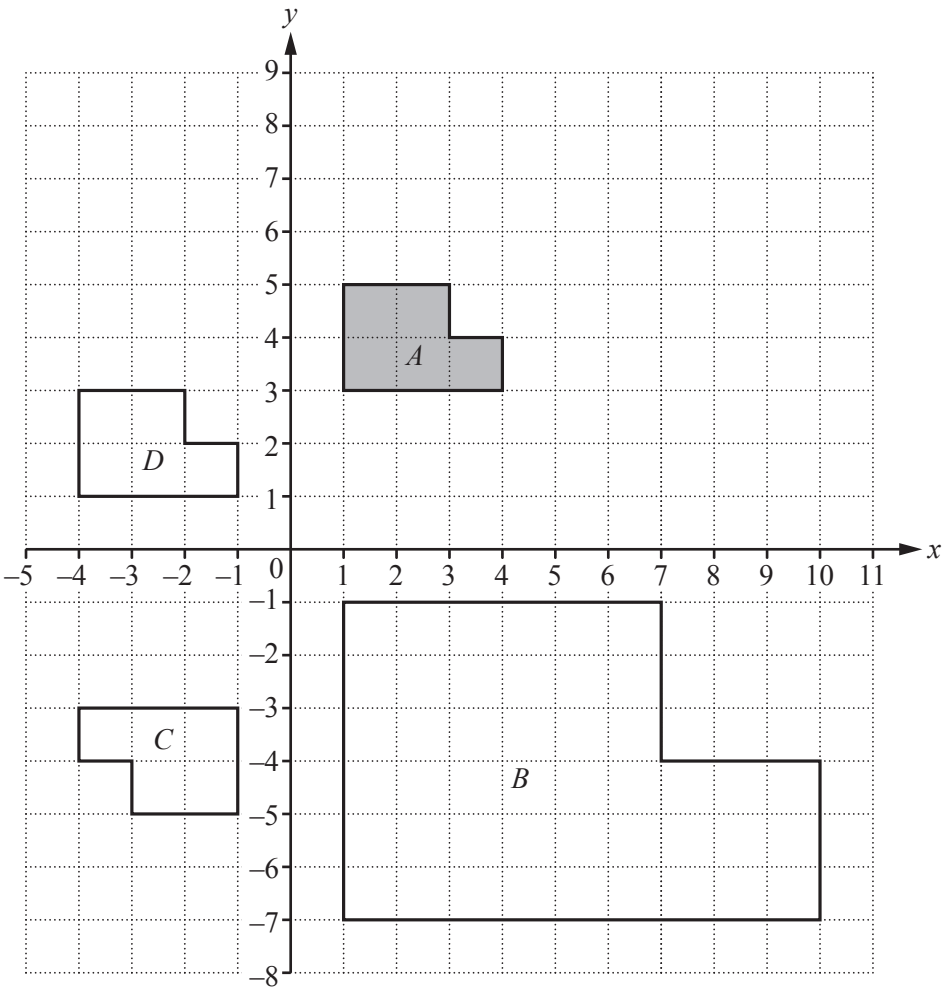

The diagram shows four shapes *A*, *B*, *C* and *D*.

(a) Describe fully the **single** transformation that maps shape *A* onto

View solution

(i) shape *B*,

Answer(a)(i) .....

..... [3]

(ii) shape *C*,

View solution

Answer(a)(ii) .....

..... [3]

(iii) shape *D*.

View solution

Answer(a)(iii) .....

..... [2]

(b) On the grid, draw the reflection of shape *A* in the line $x = 5$. [2]

© UCLES 2015

9

View solution

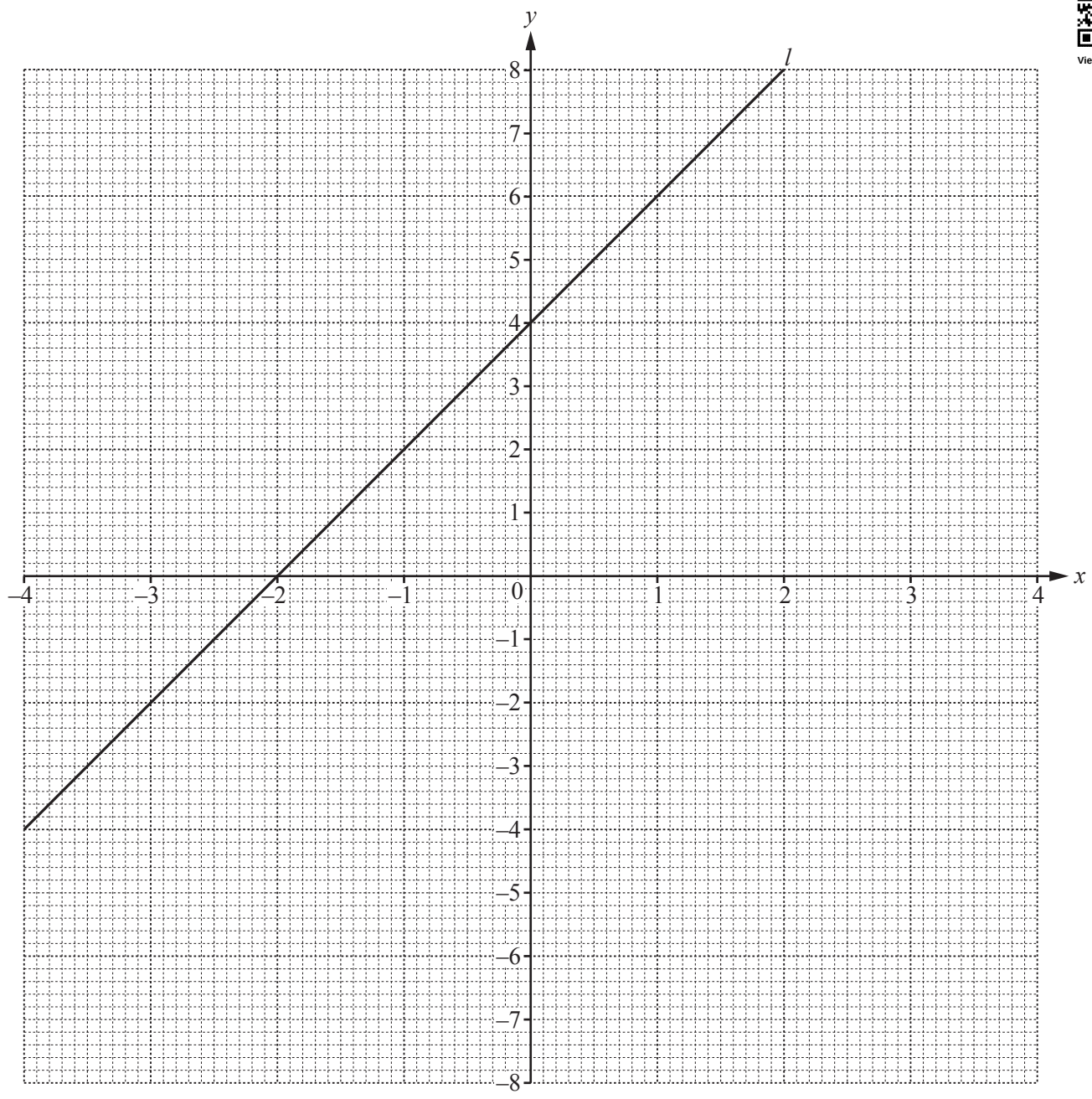

View solution

(a) Write down the equation of the line l in the form $y = mx + c$.

Answer(a) $y =$ ..... [3]

View solution

(b) Complete the table of values for $y = \frac{2}{x}$.

x	−4	−3	−2	−1	−0.5	−0.25		0.25	0.5	1	2	3	4
y		−0.7			−4				4			0.7	

[3]

(c) On the grid, draw the graph of $y = \frac{2}{x}$ for $-4 \leqslant x \leqslant -0.25$ and $0.25 \leqslant x \leqslant 4$. [4]

© UCLES 2015

10

View solution

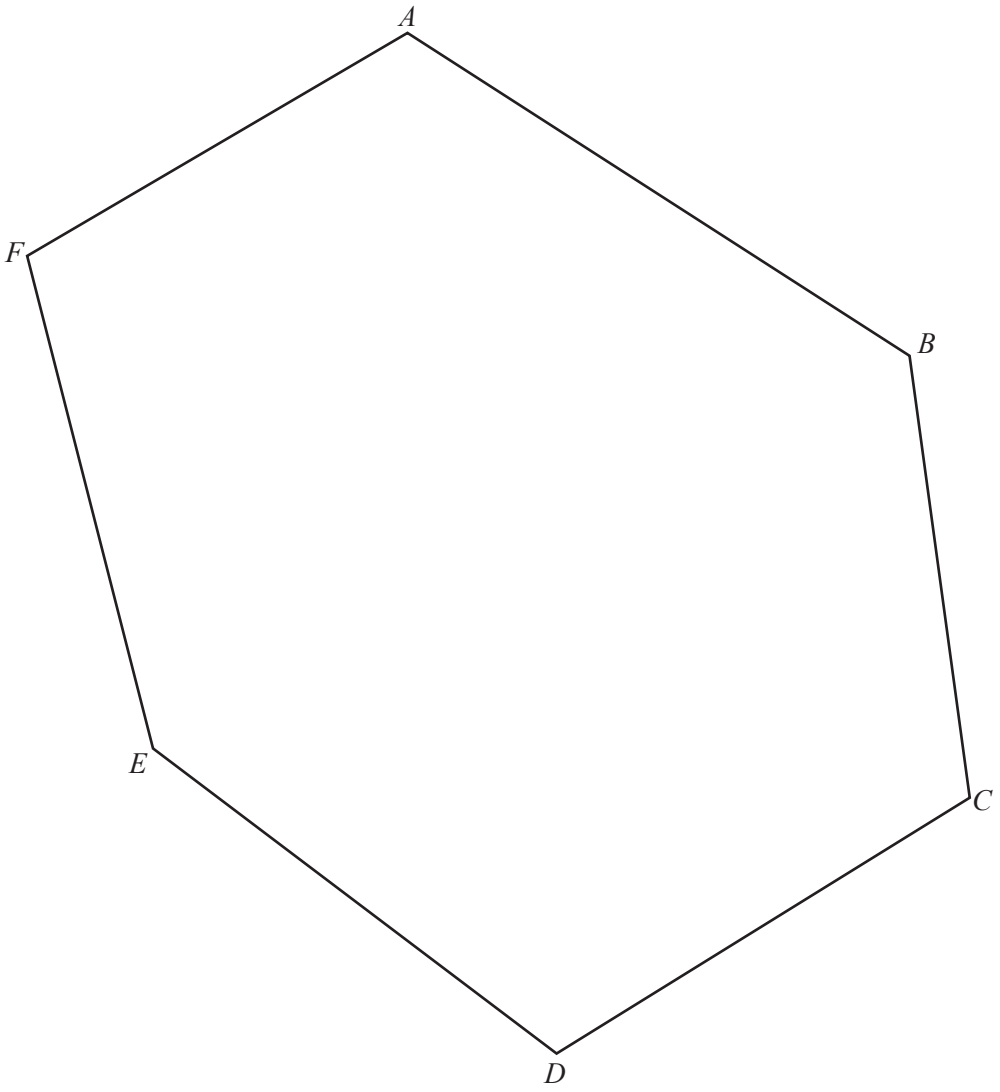

View solution

(a) Complete this part of the question using a straight edge and compasses only. Show all your construction arcs.

(i) Construct the perpendicular bisector of AB. [2]

(ii) Construct the locus of points that are equidistant from FA and FE. [2]

View solution

(b) Complete this part of the question using a ruler and compasses only.

Shade the region inside the shape that is

- more than 5 cm from D

and

- less than 4 cm from C. [3]

BLANK PAGE

Permission to reproduce items where third-party owned material protected by copyright is included has been sought and cleared where possible. Every reasonable effort has been made by the publisher (UCLES) to trace copyright holders, but if any items requiring clearance have unwittingly been included, the publisher will be pleased to make amends at the earliest possible opportunity.

To avoid the issue of disclosure of answer-related information to candidates, all copyright acknowledgements are reproduced online in the Cambridge International Examinations Copyright Acknowledgements Booklet. This is produced for each series of examinations and is freely available to download at www.cie.org.uk after the live examination series.

Cambridge International Examinations is part of the Cambridge Assessment Group. Cambridge Assessment is the brand name of University of Cambridge Local Examinations Syndicate (UCLES), which is itself a department of the University of Cambridge.