Cambridge IGCSE

Cambridge International Examinations
Cambridge International General Certificate of Secondary Education

CANDIDATE NAME									
CENTRE NUMBER						CANDIDATE NUMBER				

MATHEMATICS **0580/22**

Paper 2 (Extended) **October/November 2016**

1 hour 30 minutes

Candidates answer on the Question Paper.

Additional Materials: Electronic calculator
Tracing paper (optional)
Geometrical instruments

READ THESE INSTRUCTIONS FIRST

Write your Centre number, candidate number and name on all the work you hand in.
Write in dark blue or black pen.
You may use an HB pencil for any diagrams or graphs.
Do not use staples, paper clips, glue or correction fluid.
DO **NOT** WRITE IN ANY BARCODES.

Answer **all** questions.
If working is needed for any question it must be shown below that question.
Electronic calculators should be used.
If the degree of accuracy is not specified in the question, and if the answer is not exact, give the answer to three significant figures. Give answers in degrees to one decimal place.
For π, use either your calculator value or 3.142.

At the end of the examination, fasten all your work securely together.
The number of marks is given in brackets [ ] at the end of each question or part question.
The total of the marks for this paper is 70.

The syllabus is approved for use in England, Wales and Northern Ireland as a Cambridge International Level 1/Level 2 Certificate.

© UCLES 2016

CAMBRIDGE International Examinations

1 **(a)** Write 14 835 correct to the nearest thousand.

View solution

..... [1]

(b) Write your answer to **part (a)** in standard form.

View solution

..... [1]

2

View solution

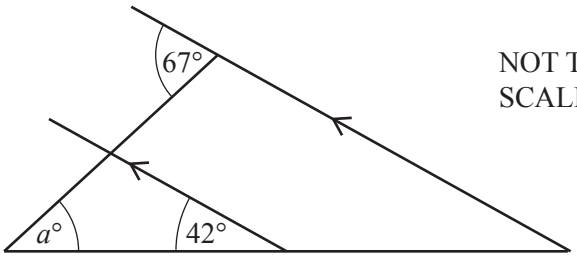

NOT TO SCALE

Find the value of a.

$a =$ ..... [2]

3 Solve the equation.

$$6(k - 8) = 78$$

View solution

$k =$ ..... [2]

4

View solution

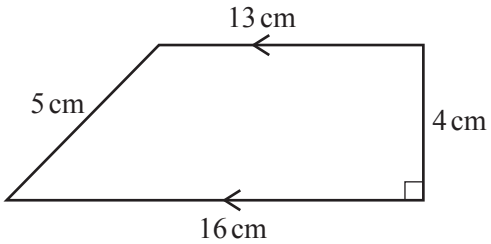

NOT TO SCALE

Calculate the area of this trapezium.

..... cm^2 [2]

© UCLES 2016

5 Simplify.

$36y^5 \div 4y^2$

View solution

..... [2]

6 The sides of a square are 8 cm, correct to the nearest centimetre.

View solution

Calculate the upper bound for the area of the square.

..... cm^2 [2]

7 Find the positive integers that satisfy the inequality $t+2 > 3t-6$.

View solution

..... [3]

8 Solve the simultaneous equations.
You must show all your working.

View solution

$$\tfrac{1}{2}x + y = 8$$
$$x - 2y = 2$$

$x =$ .....

$y =$ ..... [3]

© UCLES 2016

9 From the top of a building, 300 metres high, the angle of depression of a car, C, is 52°.

View solution

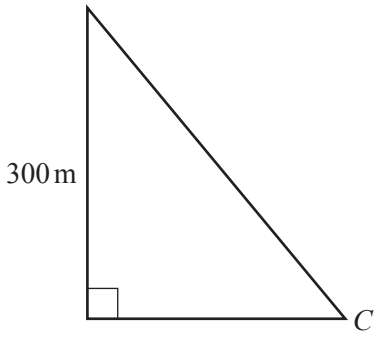

NOT TO SCALE

Calculate the horizontal distance from the car to the base of the building.

..... m [3]

10 The length of a backpack of capacity 30 litres is 53 cm.

View solution

Calculate the length of a mathematically similar backpack of capacity 20 litres.

..... cm [3]

© UCLES 2016

11

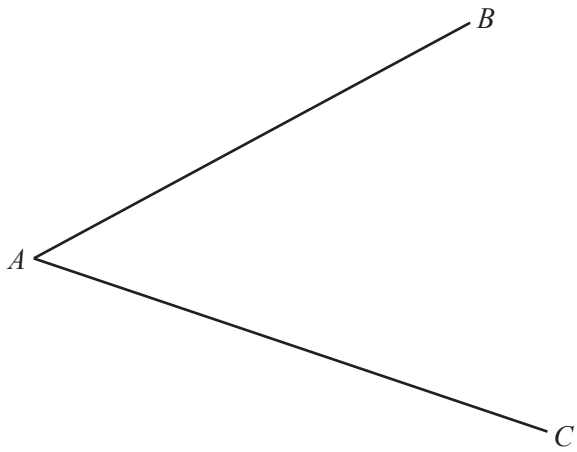

View solution

(a) **Using compasses and a straight edge only**, construct the bisector of angle *BAC*. [2]

View solution

(b) Complete the statement.

The bisector of angle *BAC* is the locus of points that are .....

..... [1]

12 Ralf and Susie share \$57 in the ratio 2 : 1.

View solution

(a) Calculate the amount Ralf receives.

\$ ..... [2]

View solution

(b) Ralf gives \$2 to Susie.

Calculate the new ratio Ralf's money : Susie's money.
Give your answer in its simplest form.

..... : .....[2]

© UCLES 2016

13 Factorise.

(a) $m^3 + m$

View solution

..... [1]

(b) $25 - y^2$

View solution

..... [1]

(c) $x^2 + 3x - 28$

View solution

..... [2]

14 **Without using your calculator**, work out $\frac{3}{4} + \frac{2}{3} - \frac{1}{8}$.

View solution

You must show all your working and give your answer as a mixed number in its simplest form.

..... [4]

© UCLES 2016

15

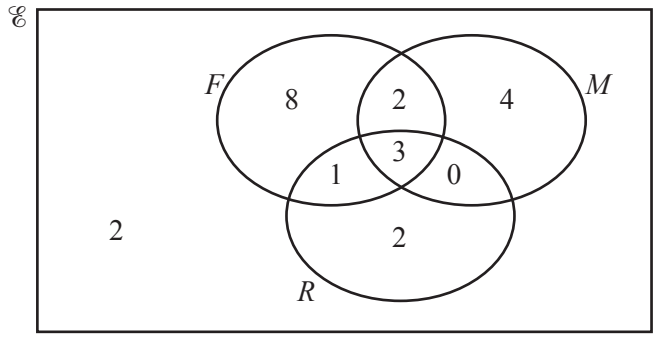

The Venn diagram shows the number of people who like films (F), music (M) and reading (R).

(a) Find

(i) $\mathrm{n}(M)$,

..... [1]

(ii) $\mathrm{n}(R \cup M)$.

..... [1]

(b) A person is chosen at random from the people who like films.

Write down the probability that this person also likes music.

..... [1]

(c) On the Venn diagram, shade $M' \cap (F \cup R)$. [1]

16 $\overrightarrow{BC} = \begin{pmatrix} 2 \\ 3 \end{pmatrix}$ $\overrightarrow{BA} = \begin{pmatrix} -5 \\ 6 \end{pmatrix}$

(a) Find $\overrightarrow{CA}$.

$\overrightarrow{CA} = \begin{pmatrix} \quad \\ \quad \end{pmatrix}$ [2]

(b) Work out $|\overrightarrow{BA}|$.

..... [2]

17

View solution

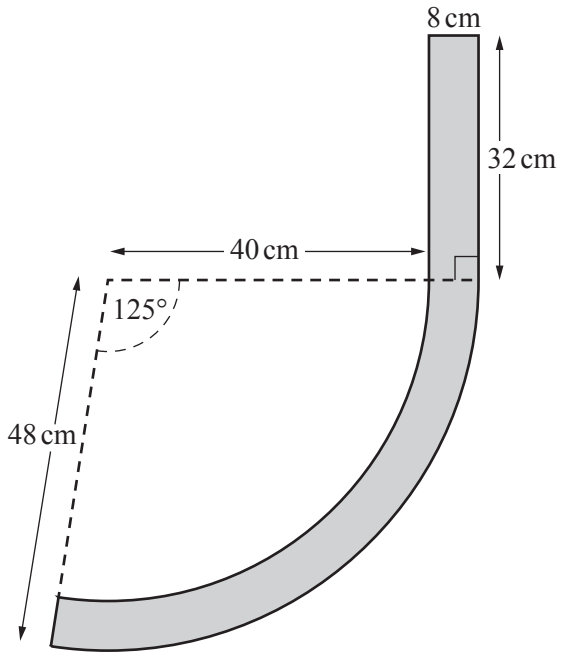

NOT TO SCALE

The diagram shows the cross section of part of a park bench.
It is made from a rectangle of length 32 cm and width 8 cm and a curved section.
The curved section is made from two concentric arcs with sector angle 125°.
The inner arc has radius 40 cm and the outer arc has radius 48 cm.

Calculate the area of the cross section correct to the nearest square centimetre.

..... cm^2 [5]

© UCLES 2016

18

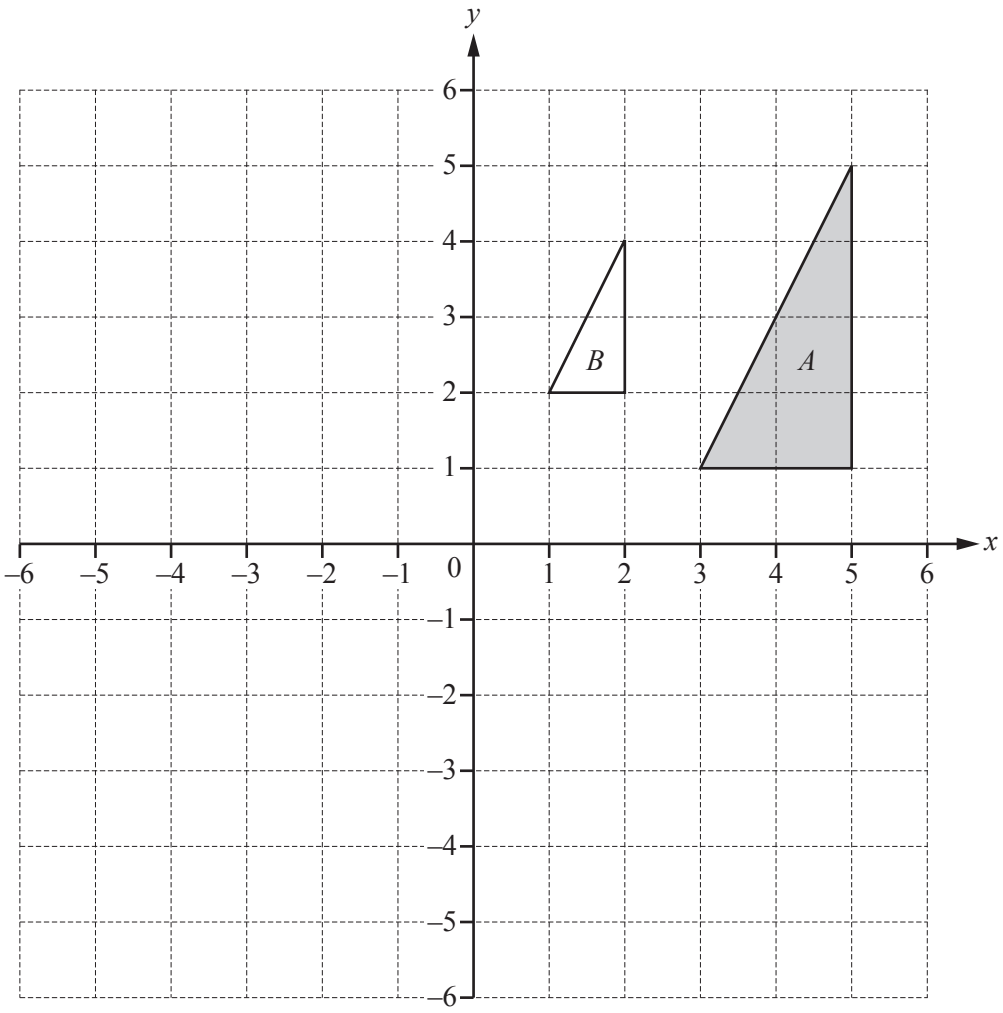

(a) Describe fully the **single** transformation that maps triangle A onto triangle B.

View solution

.....

..... [3]

(b) Draw the image of triangle A after the transformation represented by $\begin{pmatrix} 1 & 0 \\ 0 & -1 \end{pmatrix}$. [3]

View solution

19 **(a)** Find the inverse of $\begin{pmatrix} 2 & -3 \\ 5 & -4 \end{pmatrix}$.

View solution

$\begin{pmatrix} & \\ & \end{pmatrix}$ [2]

(b) The matrix $\begin{pmatrix} w & -9 \\ 4 & w-12 \end{pmatrix}$ does not have an inverse.

View solution

Calculate the value of w.

$w =$ ..... [4]

© UCLES 2016

20

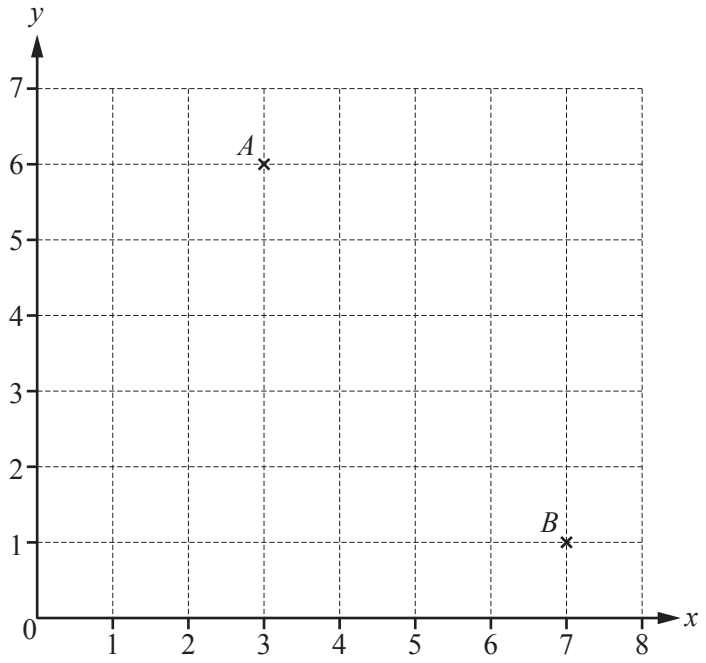

Point A has co-ordinates (3, 6).

(a) Write down the co-ordinates of point B.

View solution

(..... , ...) [1]

(b) Find the gradient of the line AB.

View solution

..... [2]

(c) Find the equation of the line that

- is perpendicular to the line AB

and

- passes through the point (0, 2).

View solution

..... [3]

BLANK PAGE

Permission to reproduce items where third-party owned material protected by copyright is included has been sought and cleared where possible. Every reasonable effort has been made by the publisher (UCLES) to trace copyright holders, but if any items requiring clearance have unwittingly been included, the publisher will be pleased to make amends at the earliest possible opportunity.

To avoid the issue of disclosure of answer-related information to candidates, all copyright acknowledgements are reproduced online in the Cambridge International Examinations Copyright Acknowledgements Booklet. This is produced for each series of examinations and is freely available to download at www.cie.org.uk after the live examination series.

Cambridge International Examinations is part of the Cambridge Assessment Group. Cambridge Assessment is the brand name of University of Cambridge Local Examinations Syndicate (UCLES), which is itself a department of the University of Cambridge.