Cambridge Assessment International Education

Cambridge IGCSE™

CANDIDATE NAME									
CENTRE NUMBER						CANDIDATE NUMBER				

MATHEMATICS **0580/22**

Paper 2 (Extended) **October/November 2020**

1 hour 30 minutes

You must answer on the question paper.

You will need: Geometrical instruments

INSTRUCTIONS

- Answer **all** questions.
- Use a black or dark blue pen. You may use an HB pencil for any diagrams or graphs.
- Write your name, centre number and candidate number in the boxes at the top of the page.
- Write your answer to each question in the space provided.
- Do **not** use an erasable pen or correction fluid.
- Do **not** write on any bar codes.
- You should use a calculator where appropriate.
- You may use tracing paper.
- You must show all necessary working clearly.
- Give non-exact numerical answers correct to 3 significant figures, or 1 decimal place for angles in degrees, unless a different level of accuracy is specified in the question.
- For π, use either your calculator value or 3.142.

INFORMATION

- The total mark for this paper is 70.
- The number of marks for each question or part question is shown in brackets [ ].

This document has **12** pages. Blank pages are indicated.

© UCLES 2020

1 Write two hundred thousand and seventeen in figures.

View solution

..... [1]

2 Insert one pair of brackets to make this calculation correct.

View solution

$$7 - 5 - 3 + 4 = 9$$

[1]

3 Solve the equation.

View solution

$$6 - 2x = 3x$$

$x =$ ..... [2]

4

View solution

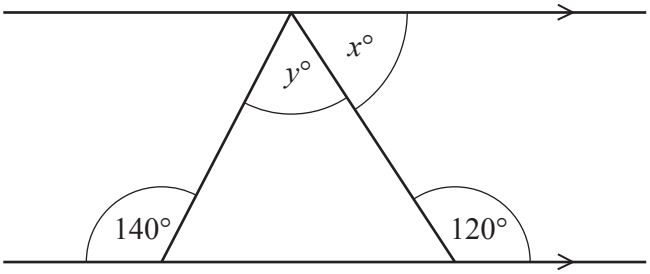

NOT TO SCALE

The diagram shows a triangle drawn between a pair of parallel lines.

Find the value of x and the value of y.

$x =$ .....

$y =$ ..... [3]

5 Increase 42 by 16%.

View solution

..... [2]

© UCLES 2020

6 Factorise completely.

$4 - 8x$

View solution

..... [1]

7

View solution

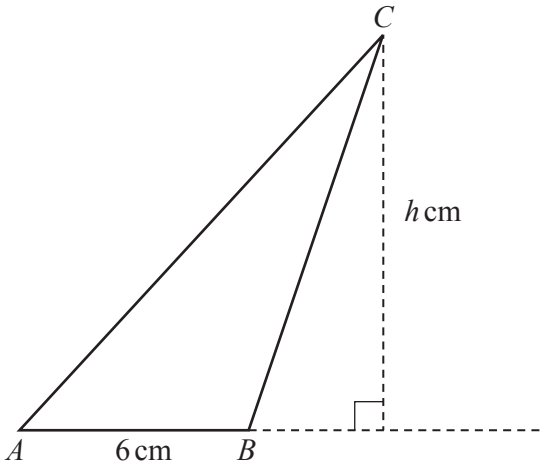

NOT TO SCALE

The area of triangle ABC is $27\,\text{cm}^2$ and $AB = 6\,\text{cm}$.

Calculate the value of h.

$h =$ ..... [2]

8 Calculate the size of one interior angle of a regular polygon with 40 sides.

View solution

..... [2]

© UCLES 2020

9 Solve the simultaneous equations.

$$2x + y = 7$$
$$3x - y = 8$$

View solution

$x =$ .....

$y =$ ..... [2]

10 **Without using a calculator**, work out $\frac{5}{6} \div 1\frac{1}{3}$.
You must show all your working and give your answer as a fraction in its simplest form.

View solution

..... [3]

11 Simplify.

$$2x^2 \times 5x^5$$

View solution

..... [2]

© UCLES 2020

12 Alex and Chris share sweets in the ratio Alex : Chris = 7 : 3.
Alex receives 20 more sweets than Chris.

View solution

Work out the number of sweets Chris receives.

..... [2]

13 The length of one side of a rectangle is 12 cm.
The length of the diagonal of the rectangle is 13 cm.

View solution

Calculate the area of the rectangle.

..... cm^2 [3]

14 Work out $(3 \times 10^{199}) + (2 \times 10^{201})$.
Give your answer in standard form.

View solution

..... [2]

© UCLES 2020

15

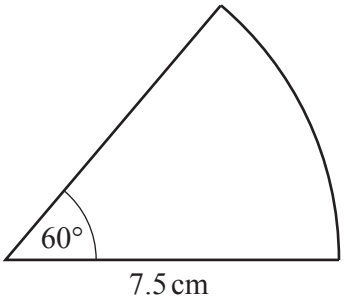

NOT TO SCALE

Calculate the area of this sector of a circle.

..... cm^2 [2]

16 The selling price of a shirt is \$26.50 .
This includes a tax of 6%.

Calculate the price of the shirt before the tax was added.

\$ ..... [2]

17

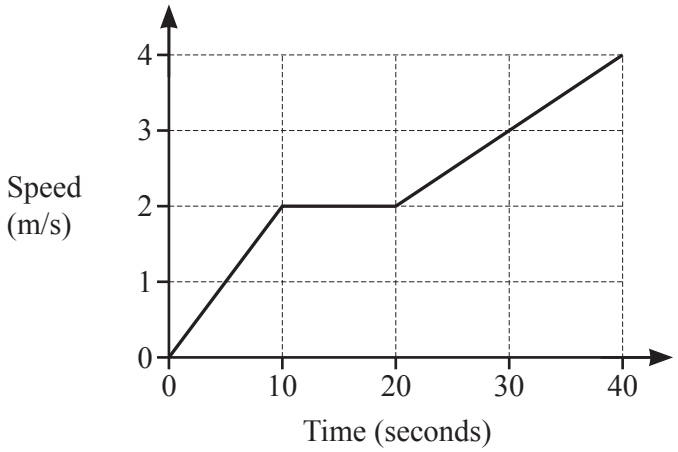

The diagram shows the speed–time graph for the first 40 seconds of a cycle ride.

(a) Find the acceleration between 20 and 40 seconds.

View solution

..... m/s^2 [1]

(b) Find the total distance travelled.

View solution

..... m [3]

18 The sides of an isosceles triangle are measured correct to the nearest millimetre. One side has a length of 8.2 cm and another has a length of 9.4 cm.

View solution

Find the largest possible value of the perimeter of this triangle.

..... cm [3]

© UCLES 2020

19

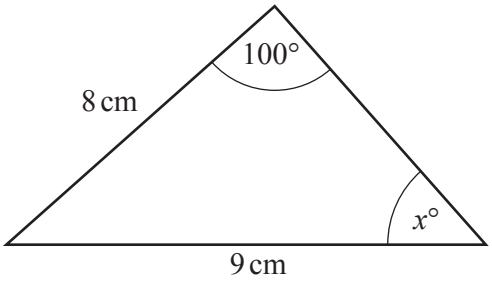

NOT TO SCALE

(a) Calculate the value of x.

View solution

$x =$ ..... [3]

(b) Calculate the area of the triangle.

View solution

..... cm^2 [3]

20 A model of a statue has a height of 4 cm.
The volume of the model is 12 cm^3.
The volume of the statue is 40 500 cm^3.

Calculate the height of the statue.

View solution

..... cm [3]

© UCLES 2020

21 **(a)** Differentiate $6+4x-x^2$.

View solution

..... [2]

(b) Find the coordinates of the turning point of the graph of $y = 6+4x-x^2$.

View solution

(..... , ...) [2]

© UCLES 2020

22

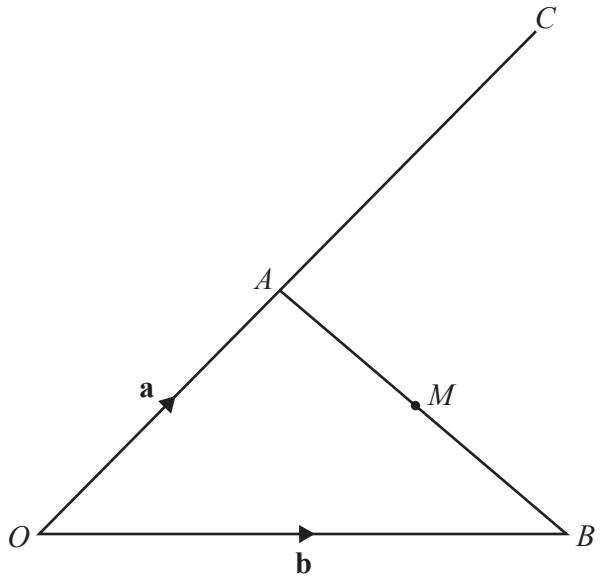

NOT TO SCALE

The diagram shows a triangle OAB and a straight line OAC.
$OA : OC = 2 : 5$ and M is the midpoint of AB.
$\overrightarrow{OA} = \mathbf{a}$ and $\overrightarrow{OB} = \mathbf{b}$.

Find, in terms of **a** and **b**, in its simplest form

(a) $\overrightarrow{AB}$,

View solution

$\overrightarrow{AB} =$ ..... [1]

(b) $\overrightarrow{MC}$.

View solution

$\overrightarrow{MC} =$ ..... [3]

23 Write as a single fraction in its simplest form.

View solution

$$2-\frac{2x-1}{x+1}$$

..... [3]

24 A line from the point (2, 3) is perpendicular to the line $y=\frac{1}{3}x+1$.
The two lines meet at the point P.

View solution

Find the coordinates of P.

(..... , ...) [5]

Questions 25 and 26 are printed on the next page.

© UCLES 2020

25 Solve the equation $\tan x = 2$ for $0° \leqslant x \leqslant 360°$.

View solution

$x =$ ..... or $x =$ ..... [2]

26 Simplify.

$$\frac{ux - 2u - x + 2}{u^2 - 1}$$

View solution

..... [4]

Permission to reproduce items where third-party owned material protected by copyright is included has been sought and cleared where possible. Every reasonable effort has been made by the publisher (UCLES) to trace copyright holders, but if any items requiring clearance have unwittingly been included, the publisher will be pleased to make amends at the earliest possible opportunity.

To avoid the issue of disclosure of answer-related information to candidates, all copyright acknowledgements are reproduced online in the Cambridge Assessment International Education Copyright Acknowledgements Booklet. This is produced for each series of examinations and is freely available to download at www.cambridgeinternational.org after the live examination series.

Cambridge Assessment International Education is part of the Cambridge Assessment Group. Cambridge Assessment is the brand name of the University of Cambridge Local Examinations Syndicate (UCLES), which itself is a department of the University of Cambridge.

© UCLES 2020