Cambridge Assessment International Education

Cambridge IGCSE™

CANDIDATE NAME									
CENTRE NUMBER						CANDIDATE NUMBER				

MATHEMATICS **0580/13**

Paper 1 (Core) **October/November 2021**

1 hour

You must answer on the question paper.

You will need: Geometrical instruments

INSTRUCTIONS

- Answer **all** questions.
- Use a black or dark blue pen. You may use an HB pencil for any diagrams or graphs.
- Write your name, centre number and candidate number in the boxes at the top of the page.
- Write your answer to each question in the space provided.
- Do **not** use an erasable pen or correction fluid.
- Do **not** write on any bar codes.
- You should use a calculator where appropriate.
- You may use tracing paper.
- You must show all necessary working clearly.
- Give non-exact numerical answers correct to 3 significant figures, or 1 decimal place for angles in degrees, unless a different level of accuracy is specified in the question.
- For π, use either your calculator value or 3.142.

INFORMATION

- The total mark for this paper is 56.
- The number of marks for each question or part question is shown in brackets [ ].

© UCLES 2021

1 Write

(a) $\frac{1}{2}$ as a percentage,

View solution

..... % [1]

(b) 0.7 as a fraction,

View solution

..... [1]

(c) $\frac{11}{20}$ as a decimal.

..... [1]

View solution

2 Points A and B are plotted on the grid.

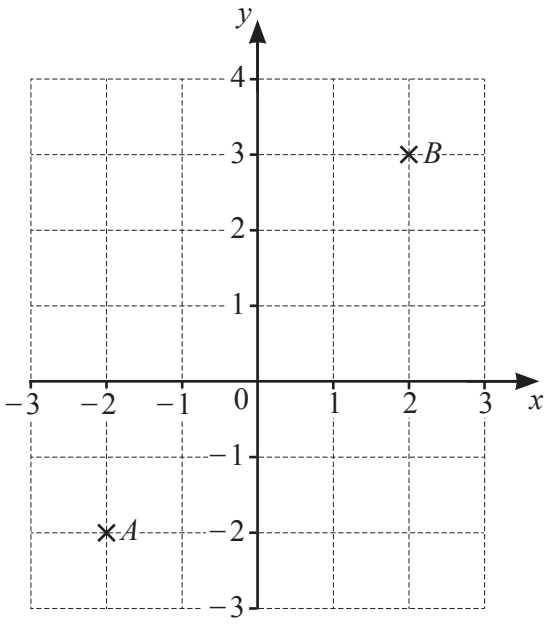

(a) Write down the coordinates of point B.

View solution

(..... , ...) [1]

(b) Write $\overrightarrow{AB}$ as a vector.

View solution

$\begin{pmatrix} \quad \\ \quad \end{pmatrix}$ [1]

(c) On the grid, plot point C at $(-2, 3)$. [1]

View solution

3 Find the number of minutes in $4\frac{1}{2}$ hours.

View solution

..... min [1]

4

View solution

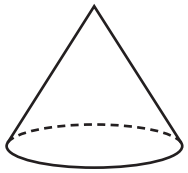

Write down the mathematical name of this solid.

..... [1]

5 Cheng spins a fair 6-sided spinner numbered 1 to 6.

View solution

On the probability scale, draw an arrow (↓) to show the probability that the spinner lands on 4.

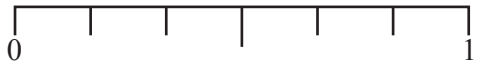

[1]

6

62 43 16 21 73 16 33 16 35

For this list of numbers find

(a) the mode,

View solution

..... [1]

(b) the median.

View solution

..... [2]

7 $r = 2t + 3u$

View solution

Work out the value of t when $r = 18$ and $u = 4$.

$t =$ ..... [2]

8 The temperature at midnight was $-8\,°C$.
The temperature at noon is $6\,°C$.

(a) Work out the difference between these two temperatures.

View solution

..... °C [1]

(b) The temperature at 7 am is $5\,°C$ higher than the temperature at midnight.

View solution

Work out the temperature at 7 am.

..... °C [1]

9 The probability that it rains tomorrow is 0.47 .

View solution

Find the probability that it does not rain tomorrow.

..... [1]

© UCLES 2021

10 Write 26 g as a percentage of 208 g.

View solution

..... % [1]

11

View solution

11 13 15 17 19

From this list, write down the number that is both a prime number and a factor of 195.

..... [1]

12 **(a)** = ≠ > <

View solution

Put a ring around each of the symbols that make this statement correct.

0.5 ..... 5% [1]

(b) Insert one pair of brackets to make this statement correct.

7 − 3 − 1 + 2 = 7 [1]

View solution

13

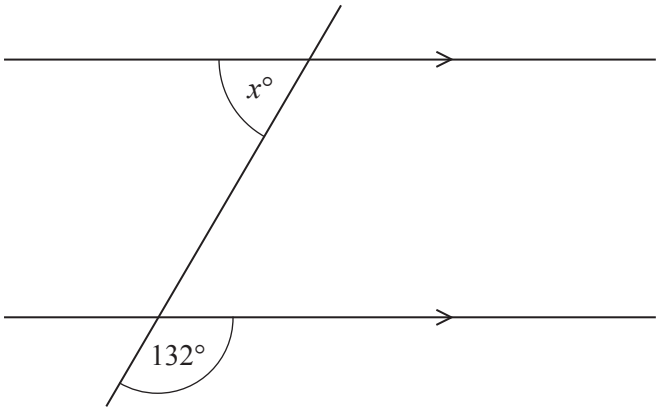

NOT TO SCALE

The diagram shows two parallel lines intersecting a straight line.

Find the value of x.

$x =$ ..... [2]

14 **(a)** These are the first four terms of a sequence.

17 23 29 35

Find the next term.

..... [1]

(b) These are the first four terms of a different sequence.

3 −1 −5 −9

(i) Find the next term in this sequence.

..... [1]

(ii) Find the nth term.

..... [2]

15 Sara takes 5 tests.
Her mean score is 62.
She takes another test and her mean score is now 68.

View solution

Work out her score in the sixth test.

..... [3]

16 Nina changes 153 euros into dollars when the exchange rate is \$1 = 0.9 euros.

View solution

Calculate the amount Nina receives.

\$ ..... [1]

17

View solution

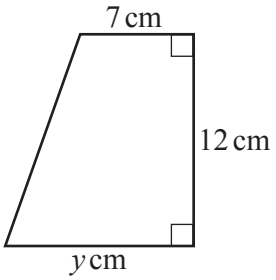

NOT TO SCALE

The area of this trapezium is 96 cm^2.

Find the value of y.

$y =$ ..... [3]

18 Marek buys a computer for $420.
He sells it at a loss of 15%.

View solution

Calculate the selling price of this computer.

$ ..... [2]

19 Calculate the radius of a circle with circumference 26 cm.

View solution

..... cm [2]

20 By writing each number in the calculation correct to 1 significant figure, find an estimate for the value of

$$\frac{4.3 \times 30.7}{6.6 - 1.8}.$$

View solution

..... [2]

21 Find the interior angle of a regular 7-sided polygon.

View solution

..... [2]

22 **Without using a calculator**, work out $\frac{11}{12} + \frac{3}{4}$.

You must show all your working and give your answer as a mixed number in its simplest form.

View solution

..... [3]

23 **(a)** Simplify.

$$32g^{32} \div 4g^4$$

View solution

..... [2]

(b) Factorise completely.

$$10j - 15j^2$$

View solution

..... [2]

(c) Expand the brackets and simplify.

$$(x+7)(x+3)$$

View solution

..... [2]

24 (a)

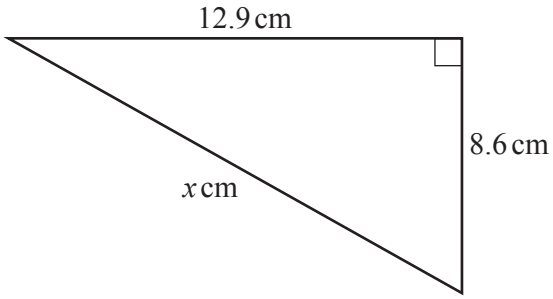

NOT TO SCALE

View solution

Calculate the value of x.

$x =$ ..... [2]

(b)

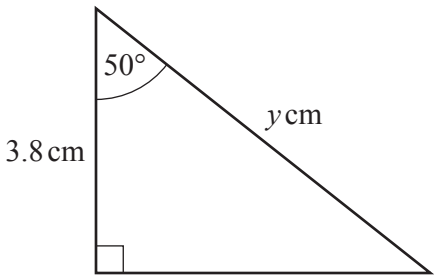

NOT TO SCALE

View solution

Show that the value of y is 5.9, correct to 2 significant figures.

[3]

BLANK PAGE

Permission to reproduce items where third-party owned material protected by copyright is included has been sought and cleared where possible. Every reasonable effort has been made by the publisher (UCLES) to trace copyright holders, but if any items requiring clearance have unwittingly been included, the publisher will be pleased to make amends at the earliest possible opportunity.

To avoid the issue of disclosure of answer-related information to candidates, all copyright acknowledgements are reproduced online in the Cambridge Assessment International Education Copyright Acknowledgements Booklet. This is produced for each series of examinations and is freely available to download at www.cambridgeinternational.org after the live examination series.

Cambridge Assessment International Education is part of the Cambridge Assessment Group. Cambridge Assessment is the brand name of the University of Cambridge Local Examinations Syndicate (UCLES), which itself is a department of the University of Cambridge.

© UCLES 2021