Cambridge Assessment International Education

Cambridge IGCSE™

CANDIDATE NAME									
CENTRE NUMBER						CANDIDATE NUMBER				

MATHEMATICS **0580/23**

Paper 2 (Extended) **October/November 2021**

1 hour 30 minutes

You must answer on the question paper.

You will need: Geometrical instruments

INSTRUCTIONS
- Answer **all** questions.
- Use a black or dark blue pen. You may use an HB pencil for any diagrams or graphs.
- Write your name, centre number and candidate number in the boxes at the top of the page.
- Write your answer to each question in the space provided.
- Do **not** use an erasable pen or correction fluid.
- Do **not** write on any bar codes.
- You should use a calculator where appropriate.
- You may use tracing paper.
- You must show all necessary working clearly.
- Give non-exact numerical answers correct to 3 significant figures, or 1 decimal place for angles in degrees, unless a different level of accuracy is specified in the question.
- For π, use either your calculator value or 3.142.

INFORMATION
- The total mark for this paper is 70.
- The number of marks for each question or part question is shown in brackets [ ].

This document has **12** pages. Any blank pages are indicated.

© UCLES 2021

1 Write 26 g as a percentage of 208 g.

View solution

..... % [1]

2

View solution

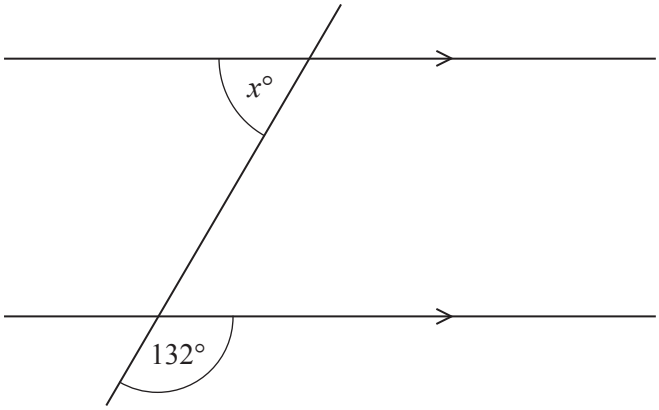

NOT TO SCALE

The diagram shows two parallel lines intersecting a straight line.

Find the value of x.

$x =$ ..... [2]

3

View solution

11 13 15 17 19

From this list, write down the number that is both a prime number and a factor of 195.

..... [1]

4 **(a)** = ≠ > <

View solution

Put a ring around each of the symbols that make this statement correct.

0.5 ..... 5% [1]

(b) Insert one pair of brackets to make this statement correct.

$7 - 3 - 1 + 2 = 7$ [1]

View solution

5 Nina changes 153 euros into dollars when the exchange rate is \$1 = 0.9 euros.

View solution

Calculate the amount Nina receives.

\$ ..... [1]

6 Marek buys a computer for \$420.
He sells it at a loss of 15%.

View solution

Calculate the selling price of this computer.

\$ ..... [2]

7 Simplify.

View solution

$$32g^{32} \div 4g^4$$

..... [2]

8 Beatrice walks 1 km at a speed of 4 km/h and then 2 km at a speed of 4.5 km/h.

View solution

Work out Beatrice's average speed for the whole journey.

..... km/h [3]

© UCLES 2021

9 Write the recurring decimal $0.\dot{2}\dot{7}$ as a fraction.

View solution

..... [1]

10 These are the first four terms of a sequence.

$$3 \quad -1 \quad -5 \quad -9$$

(a) Find the next term in this sequence.

View solution

..... [1]

(b) Find the nth term.

View solution

..... [2]

11 $P = M(g^2 + h^2)$

(a) Find the value of P when $M = 100$, $g = 3$ and $h = 4.5$.

View solution

$P =$ ..... [2]

(b) Rearrange the formula to write g in terms of P, M and h.

View solution

$g =$ ..... [3]

© UCLES 2021

12 **Without using a calculator**, work out $\frac{11}{12} + \frac{3}{4}$.
You must show all your working and give your answer as a mixed number in its simplest form.

View solution

..... [3]

13 Calculate $0.04^2 + 0.03 \times 0.28$.
Give your answer in standard form.

View solution

..... [2]

14

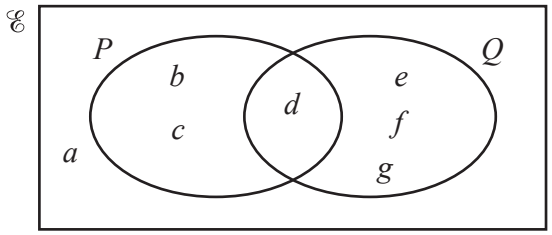

(a) Complete the statement.

View solution

$P \cup Q = \{$ ..... $\}$ [1]

(b) Find $n(Q)$.

View solution

..... [1]

(c) Find $n(P' \cap Q)$.

View solution

..... [1]

15 The cost of a train journey is increased by 6% to a new cost of \$153.70 .

View solution

Calculate the original cost of the train journey.

\$ ..... [2]

16 Jo and Mo share \$26.
Jo receives \$5 more than Mo.

View solution

Find the ratio Jo's money : Mo's money.
Give your answer in its simplest form.

..... : ..... [3]

© UCLES 2021

17 Each interior angle of a regular polygon is 178.5°.

Calculate the number of sides of this polygon.

View solution

..... [2]

18 Find the equation of the straight line that passes through the points (2, −2) and (3, 10).

View solution

Give your answer in the form $y = mx + c$.

$y =$ ..... [3]

© UCLES 2021

19

View solution

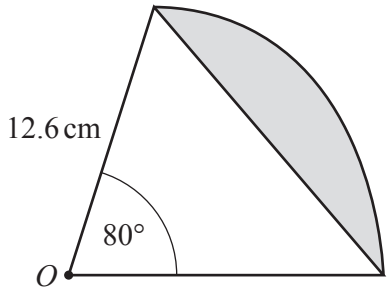

NOT TO SCALE

The diagram shows a sector of a circle, centre O, radius 12.6 cm.

Calculate the perimeter of the shaded segment.

..... cm [4]

20 A lake has an area of 3 km^2.
On a map the area of the lake is 18.75 cm^2.

View solution

Find the scale of the map in the form 1 : n.

1 : ..... [3]

© UCLES 2021

21 Simplify fully.

$$\left(243y^{10}\right)^{\frac{3}{5}}$$

View solution

..... [2]

22 Solve the simultaneous equations.
You must show all your working.

View solution

$$y = x^2 - 3x - 13$$
$$y = x - 1$$

$x =$ ..... , $y =$ .....

$x =$ ..... , $y =$ ..... [5]

© UCLES 2021

23

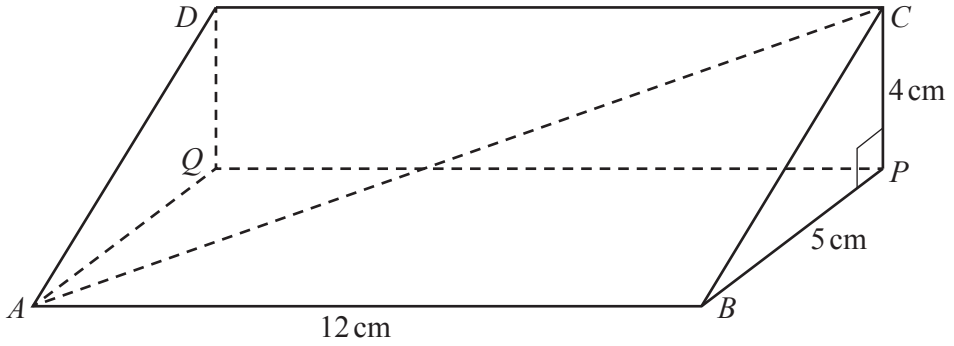

NOT TO SCALE

The diagram shows a triangular prism.
Angle $BPC = 90°$.

(a) Calculate AC.

View solution

$AC =$ ..... cm [3]

(b) Calculate the angle between AC and the base $ABPQ$.

View solution

..... [3]

24 $\tan x = \sqrt{3}$ and $0° \leqslant x \leqslant 360°$.

View solution

Find all the possible values of x.

..... [2]

25 Simplify.

$$\frac{3x^2 - 18x}{ax - 6a + 2cx - 12c}$$

View solution

..... [4]

26

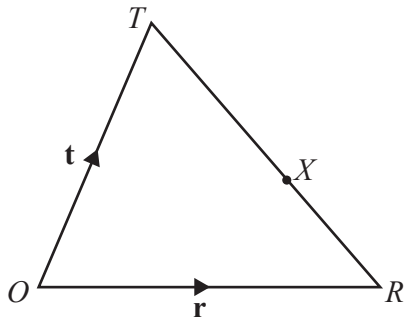

NOT TO SCALE

View solution

ORT is a triangle.
X is a point on *TR* so that $TX : XR = 3 : 2$.
O is the origin, $\overrightarrow{OR} = \mathbf{r}$ and $\overrightarrow{OT} = \mathbf{t}$.

Find the position vector of *X*.
Give your answer in terms of **r** and **t** in its simplest form.

..... [3]

BLANK PAGE

Permission to reproduce items where third-party owned material protected by copyright is included has been sought and cleared where possible. Every reasonable effort has been made by the publisher (UCLES) to trace copyright holders, but if any items requiring clearance have unwittingly been included, the publisher will be pleased to make amends at the earliest possible opportunity.

To avoid the issue of disclosure of answer-related information to candidates, all copyright acknowledgements are reproduced online in the Cambridge Assessment International Education Copyright Acknowledgements Booklet. This is produced for each series of examinations and is freely available to download at www.cambridgeinternational.org after the live examination series.

Cambridge Assessment International Education is part of the Cambridge Assessment Group. Cambridge Assessment is the brand name of the University of Cambridge Local Examinations Syndicate (UCLES), which itself is a department of the University of Cambridge.