Cambridge Assessment International Education

Cambridge IGCSE™

CANDIDATE NAME									
CENTRE NUMBER						CANDIDATE NUMBER				

MATHEMATICS **0580/23**

Paper 2 (Extended) **October/November 2022**

1 hour 30 minutes

You must answer on the question paper.

You will need: Geometrical instruments

INSTRUCTIONS

- Answer **all** questions.
- Use a black or dark blue pen. You may use an HB pencil for any diagrams or graphs.
- Write your name, centre number and candidate number in the boxes at the top of the page.
- Write your answer to each question in the space provided.
- Do **not** use an erasable pen or correction fluid.
- Do **not** write on any bar codes.
- You should use a calculator where appropriate.
- You may use tracing paper.
- You must show all necessary working clearly.
- Give non-exact numerical answers correct to 3 significant figures, or 1 decimal place for angles in degrees, unless a different level of accuracy is specified in the question.
- For π, use either your calculator value or 3.142.

INFORMATION

- The total mark for this paper is 70.
- The number of marks for each question or part question is shown in brackets [ ].

This document has **12** pages.

© UCLES 2022

1 Marco starts work at 20 45 and finishes at 02 08 the next day.

View solution

Find the length of time, in hours and minutes, he works.

..... h ..... min [1]

2

120 121 149 164 216

From this list, write down

(a) a square number

View solution

..... [1]

(b) a cube number.

View solution

..... [1]

3 Calculate.

View solution

$$\sqrt{15} + \frac{4.8}{2.2}$$

..... [1]

© UCLES 2022

4 The mean mass of four men in a rowing team is 97.5 kg.
The modal mass is 101 kg.
The range of the masses is 8 kg.

View solution

Find the mass of each of the four men.

..... kg , ... kg , ... kg, ... kg [3]

5 **Without using a calculator**, work out $\frac{5}{7} - \frac{2}{3}$.

View solution

You must show all your working and give your answer as a fraction in its simplest form.

..... [2]

6 A spinner can land on the colours green, black or red.
The table shows the probabilities of the spinner landing on green or black.

Colour	Green	Black	Red
Probability	$\frac{2}{5}$	$\frac{1}{4}$	

View solution

(a) Complete the table. [2]

(b) Chang spins the spinner 120 times.

View solution

Find the expected number of times it lands on green.

..... [1]

7 Find the lowest common multiple (LCM) of 36 and 60.

View solution

..... [2]

8 A is the point $(-3, 5)$ and B is the point $(5, 2)$.

View solution

Find the coordinates of the midpoint of the line AB.

(..... , ...) [2]

© UCLES 2022

9 Solve the simultaneous equations.

View solution

$$3x - 2y = 21$$
$$5x + 2y = 51$$

$x =$ .....

$y =$ ..... [2]

10

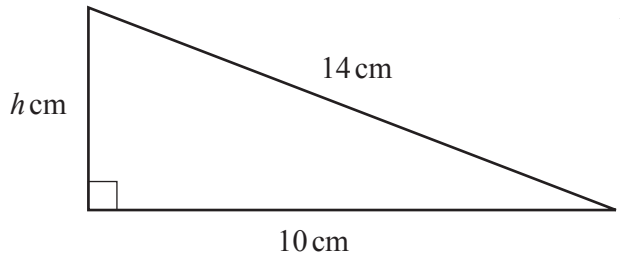

NOT TO SCALE

The diagram shows a right-angled triangle.

(a) Calculate the value of h.

View solution

$h =$ ..... [3]

(b) Find the perimeter of this triangle.

View solution

..... cm [1]

© UCLES 2022

11

View solution

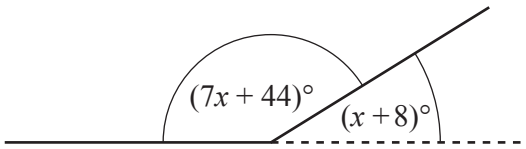

NOT TO SCALE

The diagram shows two sides of a regular polygon.
The interior angle of the polygon is $(7x + 44)°$ and the exterior angle is $(x + 8)°$.

Find the number of sides of this polygon.

..... [4]

12 Keita invests \$4000 at a rate of 2.6% per year compound interest.

View solution

Work out the interest earned on the investment at the end of 3 years.

\$ ..... [3]

13 Convert $0.2\dot{4}$ to a fraction.
You must show all your working and give your answer in its simplest form.

View solution

..... [2]

© UCLES 2022

14 A map has a scale of $1 : 200\,000$.

Find the area, in square kilometres, of a lake that has an area of $12.4\,cm^2$ on the map.

View solution

..... km^2 [2]

15 The diagram shows the speed–time graph for part of the journey of a car.

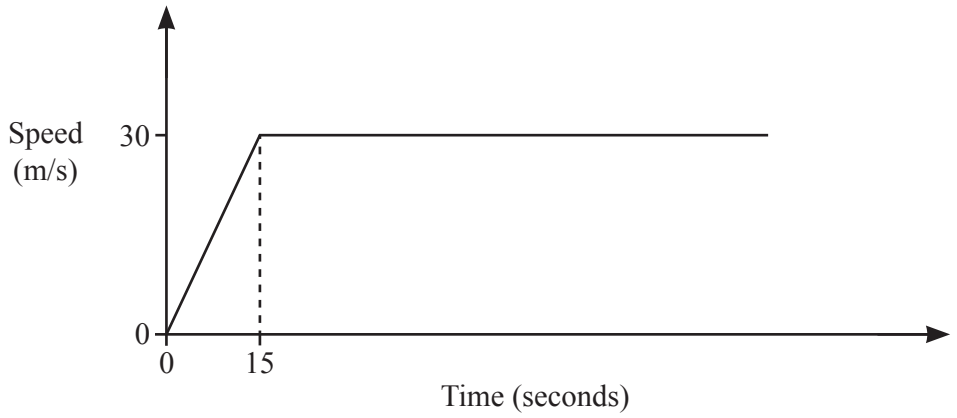

The car starts from rest and accelerates at a uniform rate for 15 seconds before reaching a constant speed of 30 m/s.

(a) Calculate the acceleration for the first 15 seconds.

View solution

..... m/s^2 [1]

(b) After T **minutes**, the total distance travelled is 45 **kilometres**.

Find the value of T.

View solution

$T =$ ..... min [4]

16 A kite is drawn on a coordinate grid.
The diagonals of the kite intersect at the point $(-2, -5)$.

View solution

One diagonal has equation $y = 4x + 3$.

Find the equation of the other diagonal of the kite.
Give your answer in the form $y = mx + c$.

$y =$ ..... [3]

17 y is proportional to the square of $(x - 7)$.
When $x = 12$, $y = 2$.

View solution

Find y when $x = 17$.

$y =$ ..... [3]

18 Two bottles are mathematically similar.
The small bottle has a capacity of 324 ml and a height of 12 cm.
The large bottle has a capacity of 768 ml.

View solution

Calculate the height of the large bottle.

..... cm [3]

© UCLES 2022

19 $f(x) = 5x - 3,\ x > 1$

$g(x) = \dfrac{10}{x-2},\ x \neq 2$

(a) Find $gf(x)$.
Give your answer in its simplest form.

View solution

..... [2]

(b) Find $g^{-1}(x)$.

View solution

$g^{-1}(x) =$ ..... [3]

(c) Find $ff^{-1}(x-1)$.

View solution

..... [1]

© UCLES 2022

20 (a)

View solution



Sketch the graph of $y = \sin x$ for $0° \leqslant x \leqslant 360°$. [2]

(b) Solve $3 - 2\sin x = \frac{13}{4}$ for $0° \leqslant x \leqslant 360°$.

View solution

$x =$ ..... or $x =$ ..... [3]

21

View solution

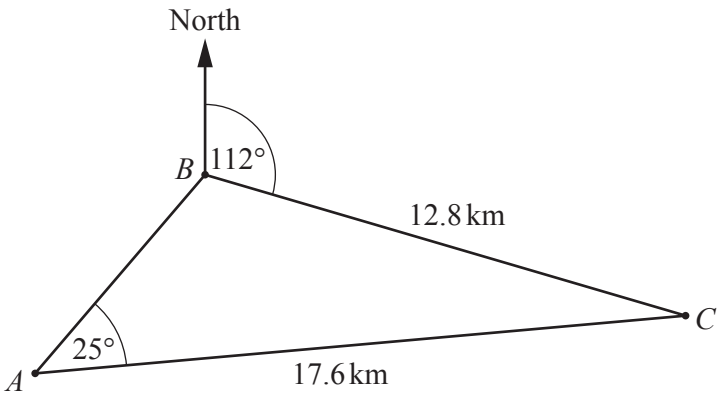

NOT TO SCALE

The diagram shows the positions of three ships A, B and C.
$AC = 17.6$ km, $BC = 12.8$ km and angle $BAC = 25°$.
The bearing of C from B is 112° and angle ABC is obtuse.

Calculate the bearing of B from A.

..... [5]

Question 22 is printed on the next page.

© UCLES 2022

22 **(a)** Expand and simplify.

$$(2x-1)(x+4)(x-3)$$

View solution

..... [3]

(b) Write as a single fraction in its simplest form.

View solution

$$\frac{4}{2x-3} \div \frac{2x^2+14x}{2x^2+11x-21}$$

..... [4]

Permission to reproduce items where third-party owned material protected by copyright is included has been sought and cleared where possible. Every reasonable effort has been made by the publisher (UCLES) to trace copyright holders, but if any items requiring clearance have unwittingly been included, the publisher will be pleased to make amends at the earliest possible opportunity.

To avoid the issue of disclosure of answer-related information to candidates, all copyright acknowledgements are reproduced online in the Cambridge Assessment International Education Copyright Acknowledgements Booklet. This is produced for each series of examinations and is freely available to download at www.cambridgeinternational.org after the live examination series.

Cambridge Assessment International Education is part of Cambridge Assessment. Cambridge Assessment is the brand name of the University of Cambridge Local Examinations Syndicate (UCLES), which is a department of the University of Cambridge.