Cambridge Assessment International Education

Cambridge IGCSE™

CANDIDATE NAME									
CENTRE NUMBER						CANDIDATE NUMBER				

MATHEMATICS **0580/23**

Paper 2 (Extended) **October/November 2023**

1 hour 30 minutes

You must answer on the question paper.

You will need: Geometrical instruments

INSTRUCTIONS

- Answer **all** questions.
- Use a black or dark blue pen. You may use an HB pencil for any diagrams or graphs.
- Write your name, centre number and candidate number in the boxes at the top of the page.
- Write your answer to each question in the space provided.
- Do **not** use an erasable pen or correction fluid.
- Do **not** write on any bar codes.
- You should use a calculator where appropriate.
- You may use tracing paper.
- You must show all necessary working clearly.
- Give non-exact numerical answers correct to 3 significant figures, or 1 decimal place for angles in degrees, unless a different level of accuracy is specified in the question.
- For π, use either your calculator value or 3.142.

INFORMATION

- The total mark for this paper is 70.
- The number of marks for each question or part question is shown in brackets [ ].

This document has **12** pages.

© UCLES 2023

1 Tara goes on a journey by train.
The train leaves at 06 48.
The journey takes 12 hours and 35 minutes.

View solution

Find the time when Tara arrives.

..... [1]

2

61	63	64	66	68	69

From this list, write down

(a) a cube number

View solution

..... [1]

(b) a prime number.

..... [1]

3 The stem-and-leaf diagram shows the heights, in centimetres, of some plants.

View solution

10	4 8
11	1 3 4 6
12	2 3 6 9
13	2 6 9

Key: 10 \| 4 represents 10.4 cm

(a) Find the median height.

View solution

..... cm [1]

(b) Work out the mean height.

View solution

..... cm [2]

4 Shubhu invests $750 in a savings account for 5 years.
The account pays simple interest at a rate of 1.8% per year.

View solution

Calculate the total interest she earns during the 5 years.

$ ..... [2]

5

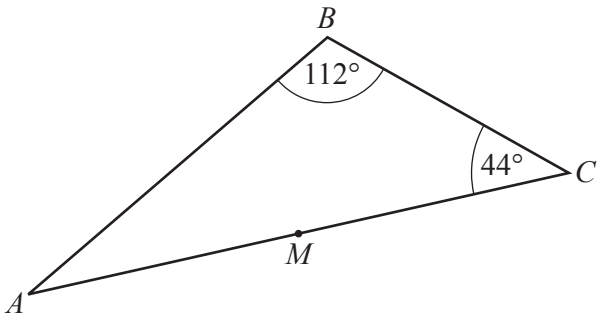

NOT TO SCALE

The diagram shows triangle *ABC*.
M is the midpoint of *AC*.

Triangle *ABC* is rotated 180° about centre *M*.
The image and the original triangle together form a quadrilateral *ABCD*.

(a) Write down the mathematical name of the quadrilateral *ABCD*.

View solution

..... [1]

(b) Find angle *BAD*.

View solution

Angle *BAD* = ... [2]

© UCLES 2023

6 Rama asks a group of students how they travel to school.
The table shows the probability of how a student, chosen at random, travels to school.

	Bus	Walk	Car	Other
Probability	0.4	0.32	0.17	

View solution

(a) Complete the table.

[2]

View solution

(b) There are 1800 students at the school.

Find the expected number of students that walk to school.

..... [1]

View solution

7 **Without using a calculator**, work out $1\frac{5}{6} \div \frac{11}{15}$.

You must show all your working and give your answer as a mixed number in its simplest form.

..... [3]

8 Find the highest common factor (HCF) of 48 and 80.

View solution

..... [2]

9 $P = \dfrac{2wy^2}{3}$

View solution

Find the positive value of y when $P = 108$ and $w = 8$.

$y =$ ..... [3]

10 $\overrightarrow{AB} = \begin{pmatrix} 7 \\ -3 \end{pmatrix}$

(a) Find $3\overrightarrow{AB}$.

View solution

$\begin{pmatrix} \quad \\ \quad \end{pmatrix}$ [1]

(b) Find $\left|\overrightarrow{AB}\right|$.

View solution

$\left|\overrightarrow{AB}\right| =$ ..... [2]

© UCLES 2023

11 A bronze sphere has radius 3.6 cm.
The density of bronze is 8.05 g/cm^3.

View solution

Find the mass of the sphere.
Give your answer **in kilograms**, correct to the nearest gram.

[The volume, V, of a sphere with radius r is $V = \frac{4}{3}\pi r^3$.]

[Density = mass ÷ volume.]

..... kg [4]

12 Oliver sent 22% more messages in June than in May.
He sent 305 messages in June.

View solution

Find how many more messages he sent in June than in May.

..... [3]

13 The graph of $y = 2x + 1$ is drawn on the grid.

View solution

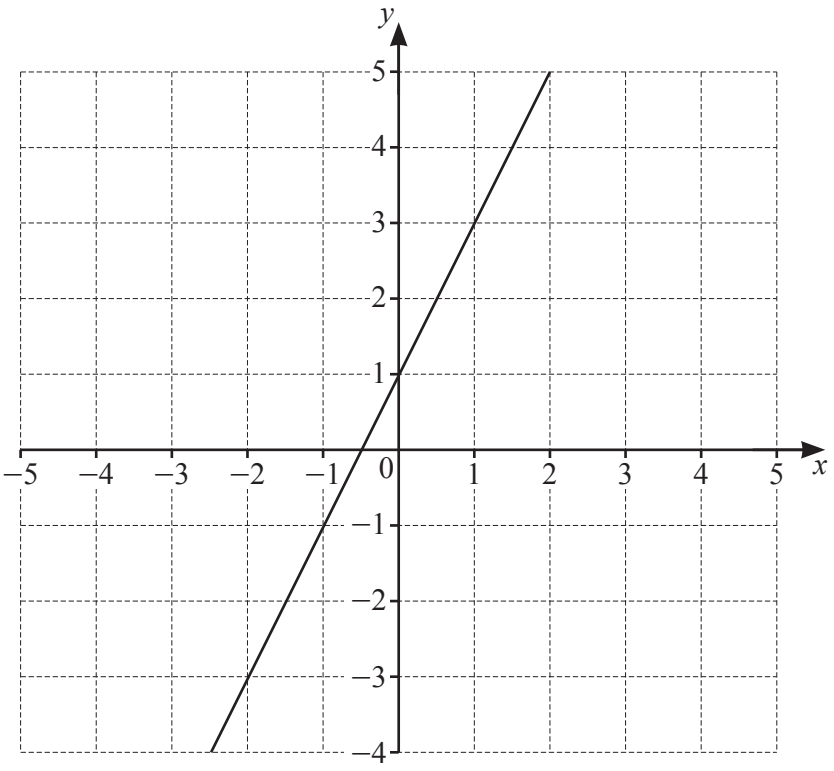

By shading the **unwanted** regions of the grid, find and label the region R which satisfies these inequalities.

$y \geqslant 2x + 1$ $y \geqslant 1$ $4x + 3y < 12$ [4]

14 The box-and-whisker plot shows information about the mass, in kg, of some parcels.

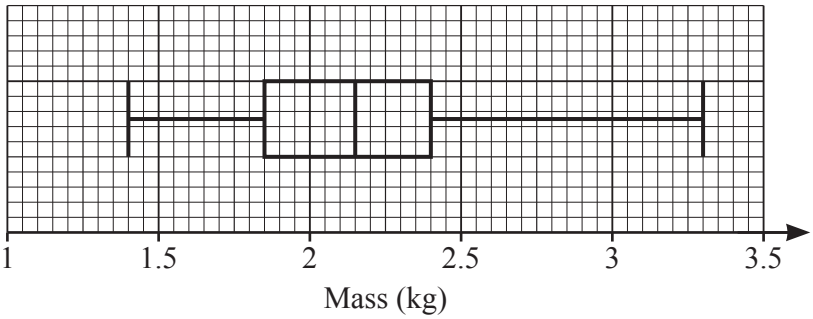

(a) Find the mass of the heaviest parcel.

View solution

..... kg [1]

(b) Find the interquartile range.

View solution

..... kg [1]

© UCLES 2023

15 $T = \sqrt{3d - e}$

View solution

Rearrange the formula to make d the subject.

$d =$ ..... [3]

16 A cylinder with height 12.5 cm has a curved surface area of 105π cm^2.

View solution

Calculate the volume of the cylinder.

..... cm^3 [4]

17 **(a)** Simplify.

View solution

$$\left(64y^{27}\right)^{\frac{2}{3}}$$

..... [2]

(b) Simplify.

View solution

$$\frac{x-5}{x^2-25}$$

..... [2]

© UCLES 2023

18 F is proportional to the product of m and a.

Calculate the percentage change in F when m is increased by 40% and a is decreased by 15%.

View solution

..... % [3]

19

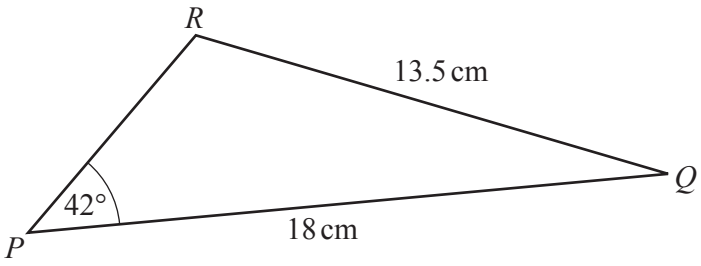

NOT TO SCALE

View solution

Calculate the obtuse angle PRQ.

Angle PRQ = ... [4]

20 $(x+a)(x+2)(2x+3)$ is equivalent to $2x^3+bx^2+cx-18$.

Find the value of each of a, b and c.

View solution

$a =$ .....

$b =$ .....

$c =$ ..... [3]

21

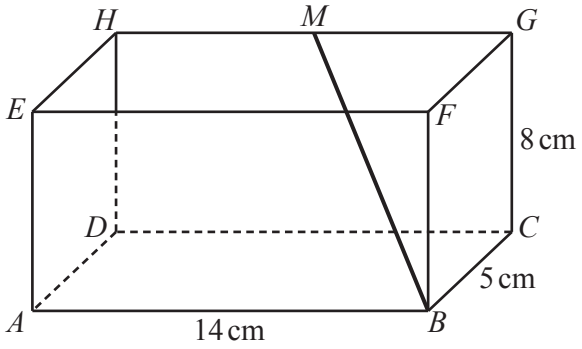

NOT TO SCALE

The diagram shows a cuboid $ABCDEFGH$.
$AB = 14$ cm, $BC = 5$ cm and $CG = 8$ cm.
M is the midpoint of HG.

(a) Calculate BM.

View solution

..... cm [3]

(b) Calculate the angle that BM makes with the base $ABCD$.

View solution

..... [3]

Question 22 is printed on the next page.

22 Find the coordinates of the point where the line $4x+y=9$ intersects the curve $y+x^2=5$.
You must show all your working.

View solution

(..... , ...) [5]

Permission to reproduce items where third-party owned material protected by copyright is included has been sought and cleared where possible. Every reasonable effort has been made by the publisher (UCLES) to trace copyright holders, but if any items requiring clearance have unwittingly been included, the publisher will be pleased to make amends at the earliest possible opportunity.

To avoid the issue of disclosure of answer-related information to candidates, all copyright acknowledgements are reproduced online in the Cambridge Assessment International Education Copyright Acknowledgements Booklet. This is produced for each series of examinations and is freely available to download at www.cambridgeinternational.org after the live examination series.

Cambridge Assessment International Education is part of Cambridge Assessment. Cambridge Assessment is the brand name of the University of Cambridge Local Examinations Syndicate (UCLES), which is a department of the University of Cambridge.

© UCLES 2023