Cambridge Assessment International Education

Cambridge IGCSE™

CANDIDATE NAME									
CENTRE NUMBER						CANDIDATE NUMBER				

MATHEMATICS **0580/11**

Paper 1 Non-calculator (Core) **October/November 2025**

1 hour 30 minutes

You must answer on the question paper.

You will need: Geometrical instruments

INSTRUCTIONS
- Answer **all** questions.
- Use a black or dark blue pen. You may use an HB pencil for any diagrams or graphs.
- Write your name, centre number and candidate number in the boxes at the top of the page.
- Write your answer to each question in the space provided.
- Do **not** use an erasable pen or correction fluid.
- Do **not** write on any bar codes.
- Calculators must **not** be used in this paper.
- You may use tracing paper.
- You must show all necessary working clearly.

INFORMATION
- The total mark for this paper is 80.
- The number of marks for each question or part question is shown in brackets [ ].

This document has **16** pages.

© UCLES 2025

List of formulas

Area, A, of triangle, base b, height h.	$A = \frac{1}{2}bh$
Area, A, of circle of radius r.	$A = \pi r^2$
Circumference, C, of circle of radius r.	$C = 2\pi r$
Curved surface area, A, of cylinder of radius r, height h.	$A = 2\pi rh$
Curved surface area, A, of cone of radius r, sloping edge l.	$A = \pi rl$
Surface area, A, of sphere of radius r.	$A = 4\pi r^2$
Volume, V, of prism, cross-sectional area A, length l.	$V = Al$
Volume, V, of pyramid, base area A, height h.	$V = \frac{1}{3}Ah$
Volume, V, of cylinder of radius r, height h.	$V = \pi r^2 h$
Volume, V, of cone of radius r, height h.	$V = \frac{1}{3}\pi r^2 h$
Volume, V, of sphere of radius r.	$V = \frac{4}{3}\pi r^3$

© UCLES 2025

Calculators must **not** be used in this paper.

1 **(a)** Write the number four hundred and sixty thousand and five in figures.

View solution

..... [1]

(b) Write 52 149 correct to the nearest hundred.

..... [1]

2

View solution

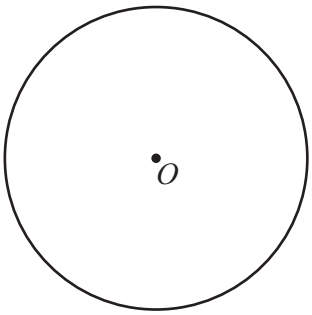

The diagram shows a circle, centre O.
On the diagram

View solution

(a) draw a diameter [1]

View solution

(b) mark a point on the circumference and label it C. [1]

3

View solution

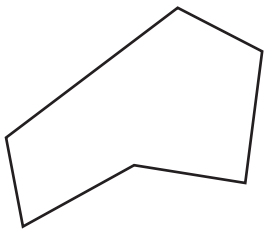

Write down the mathematical name of this polygon.

..... [1]

4 **(a)** Write down all the factors of 24.

View solution

..... [2]

(b) Write down the reciprocal of $\frac{3}{7}$.

View solution

..... [1]

5 In triangle ABC, $AB = 8\,\text{cm}$ and $BC = 6.4\,\text{cm}$.

View solution

Using a ruler and compasses only, construct triangle ABC.
Leave in your construction arcs.
The line AC has been drawn for you.



[2]

6 Shade **one** square so that the diagram has rotational symmetry of order 4.

View solution



[1]

7 These are the first four terms of a sequence.

9 5 1 −3

(a) Find the next term.

View solution

..... [1]

(b) Explain how you worked out your answer.

View solution

..... [1]

8 $p = 3q - 2r$

View solution

Work out the value of q when $p = 50$ and $r = 5$.

$q =$ ..... [2]

9 **(a)** Shade $\frac{3}{4}$ of this grid.

View solution

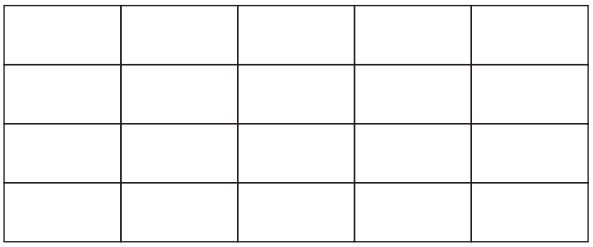

[1]

(b) Work out 15% of 80.

View solution

..... [2]

10 The bar chart shows the number of books sold in a shop in each of five months.

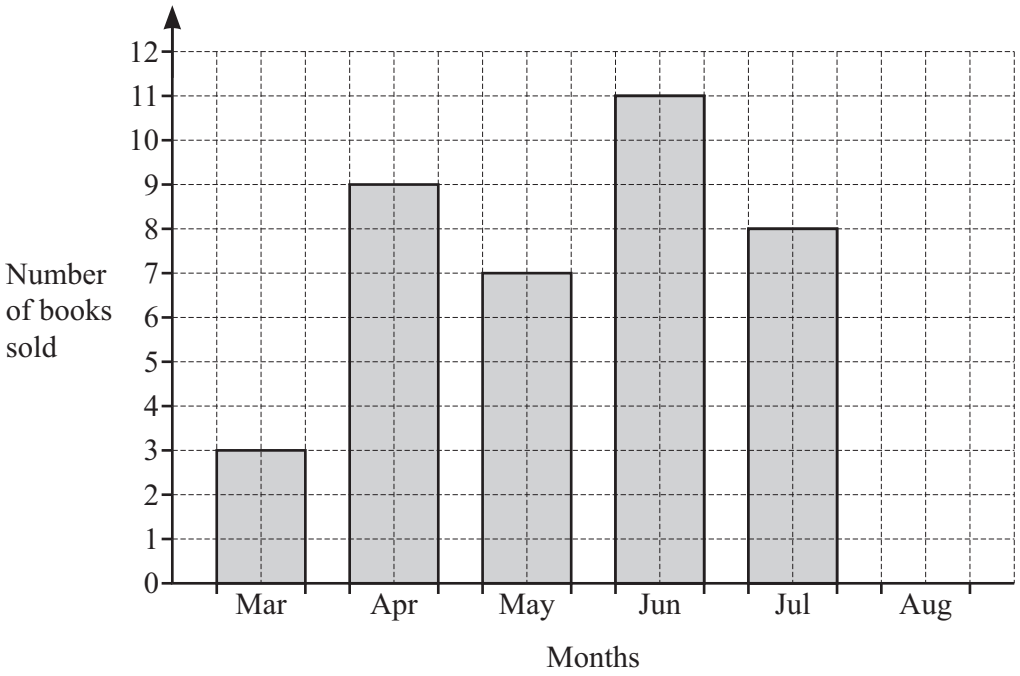

(a) 4 books were sold in August.

Complete the bar chart. [1]

View solution

(b) Calculate the mean number of books sold in the six months.

View solution

..... [2]

11 The temperature at midnight is $-2\,°C$.
The temperature at noon is $5\,°C$.

(a) Find the difference between these temperatures.

View solution

..... °C [1]

(b) The temperature at 9 am is $8\,°C$ higher than the temperature at midnight.

Work out the temperature at 9 am.

View solution

..... °C [1]

© UCLES 2025

12

View solution

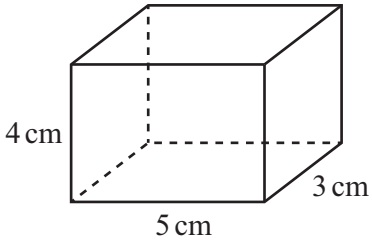

NOT TO SCALE

Complete the net of this cuboid on the 1 cm^2 grid.
One face has been drawn for you.

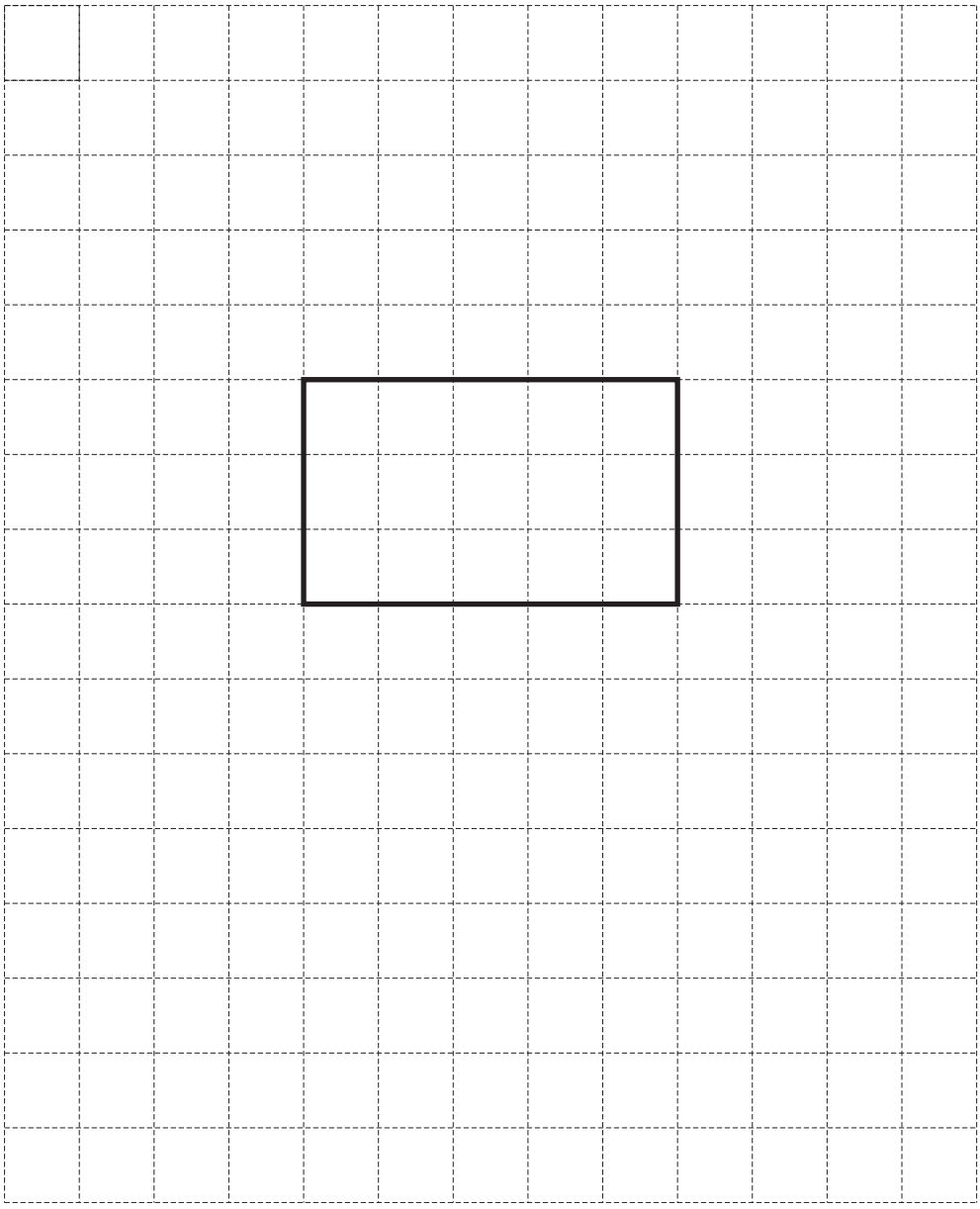

[3]

13 The scale drawing shows the positions of town *A* and town *B*.
The scale is 1 centimetre represents 10 kilometres.





Scale: 1 cm to 10 km

(a) Work out the actual distance from town *A* to town *B*.

View solution

..... km [2]

(b) Measure the bearing of town *B* from town *A*.

View solution

..... [1]

(c) Town *C* is 45 km from town *A* on a bearing of 310°.

On the scale drawing, mark the position of town *C*. [2]

View solution

14 These are the ages, in **months**, of each of 12 children.

11	27	8	10	26	17	28	12	9	13	22	12

(a) Complete the stem-and-leaf diagram to show this information.

View solution

0	
1	
2	

Key: 1 | 7 represents 17 months [2]

(b) Find the number of children over 2 **years** old.

View solution

..... [1]

(c) Show that the median is 12.5 .

View solution

[1]

15

View solution

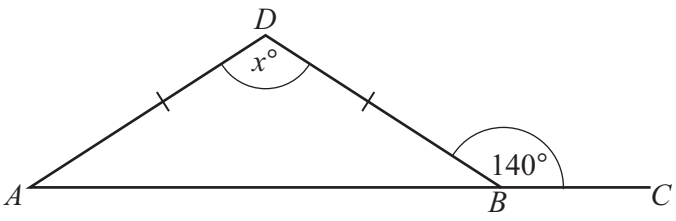

NOT TO SCALE

ABC is a straight line and *ABD* is an isosceles triangle.

Work out the value of x.

$x =$ ..... [3]

16 **(a)** Complete the table of values for $y = \frac{9}{x}$.

x	−4.5	−3	−2	−1.5	−1		1	1.5	2	3	4.5
y	−2	−3		−6	−9		9	6	4.5		2

[2]

(b) On the grid, draw the graph of $y = \frac{9}{x}$ for $-4.5 \leqslant x \leqslant -1$ and $1 \leqslant x \leqslant 4.5$.

View solution

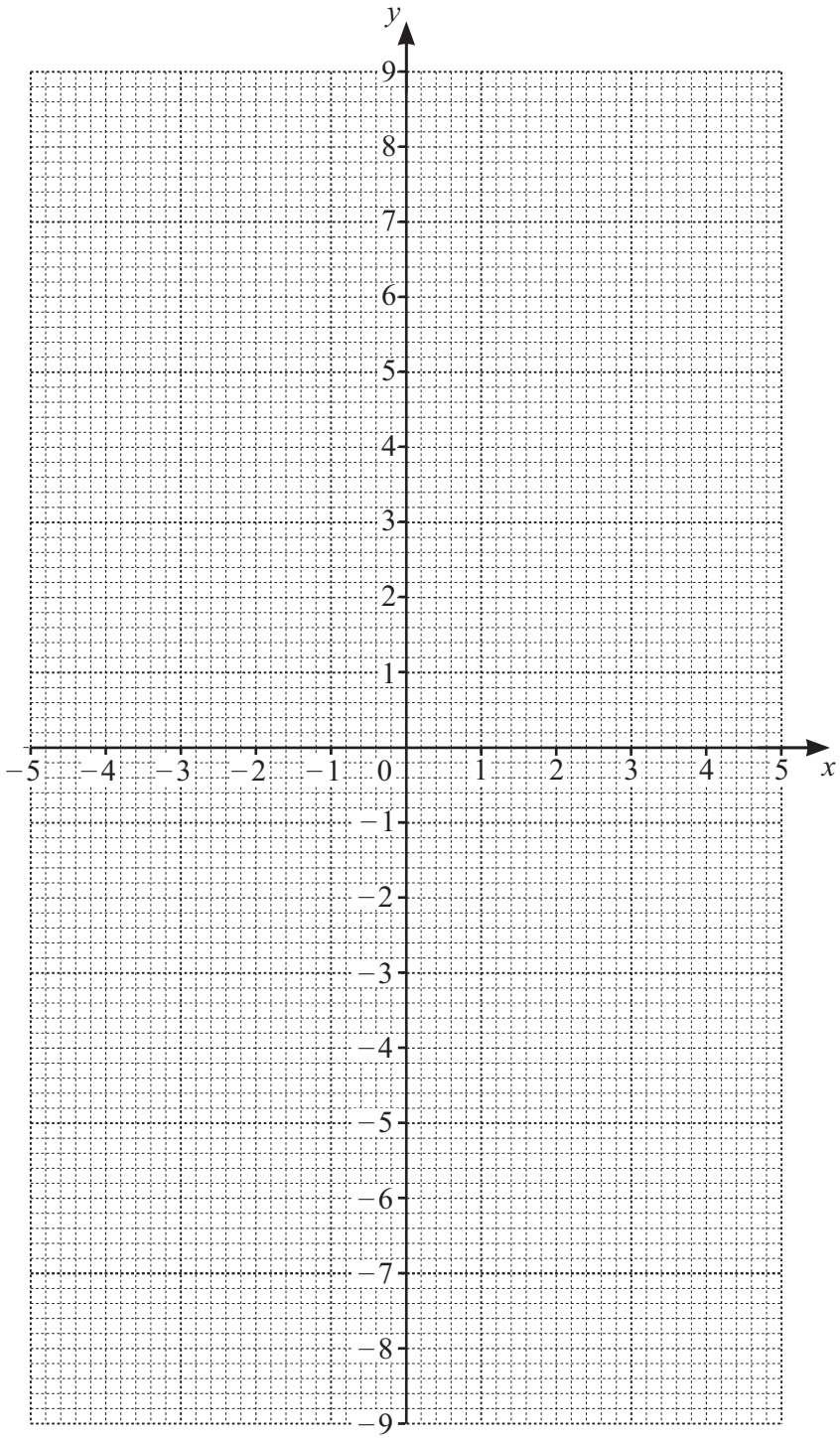

[4]

17 **(a)** Write down a prime number between 20 and 30.

View solution

..... [1]

(b) Simplify $\left(\sqrt{9}\right)^2$.

View solution

..... [1]

18 Work out $\frac{11}{18} - \frac{2}{9}$.

View solution

Give your answer as a fraction in its simplest form.

..... [2]

19 By writing each number in the calculation correct to 1 significant figure, find an estimate for the value of

$$\frac{5.3 \times 19.5}{2.49}.$$

View solution

..... [2]

20 Some students take a test.
75 of the students pass the test.
This is $\frac{3}{5}$ of the students who take the test.

View solution

Work out how many students take the test.

..... [2]

© UCLES 2025

21 Shapes A and B are shown on the grid.

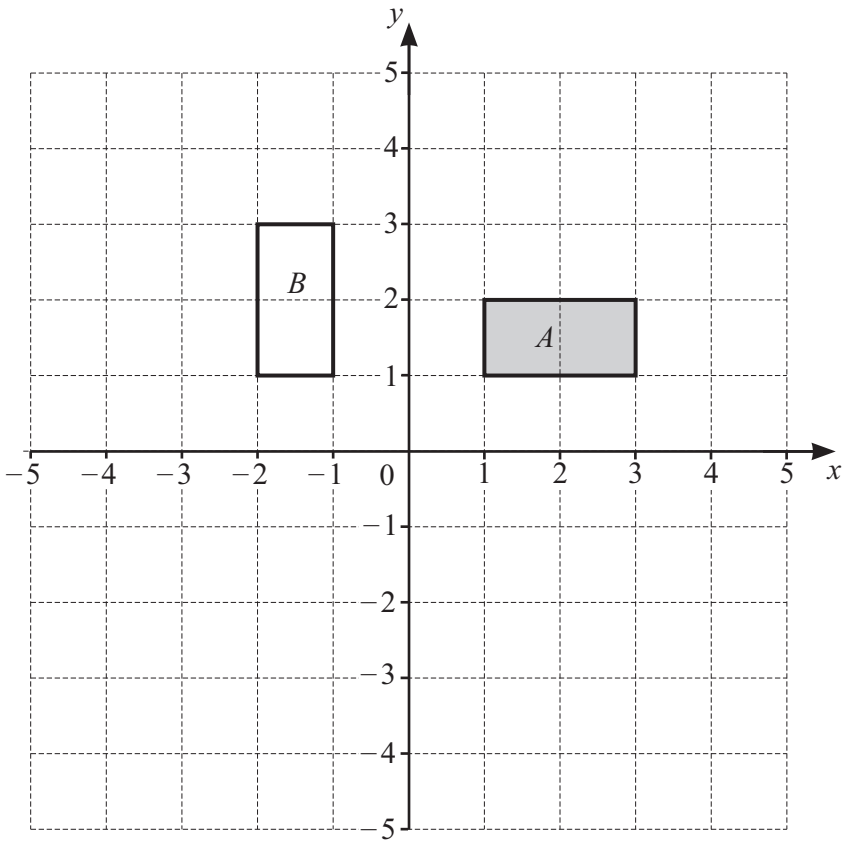

(a) Describe fully the **single** transformation that maps shape A onto shape B.

View solution

.....

..... [3]

(b) Draw the image of shape A after a reflection in the line $y = -1$. [2]

View solution

22

Chocolate cookies Makes 12 100 g flour 55 g butter 55 g sugar 20 g cocoa 1 egg

(a) Sunita makes 24 chocolate cookies.

View solution

Work out how much flour she needs.

..... g [1]

(b) Albie has 28 g of cocoa.

View solution

Does he have enough cocoa to make 18 cookies?
Explain how you decide.

.....

..... [2]

23 (a) $a^8 \times a^x = a^{15}$

View solution

Find the value of x.

$x =$ ..... [1]

(b) $(b^7)^y = b^{21}$

View solution

Find the value of y.

$y =$ ..... [1]

© UCLES 2025

24 $\mathscr{E}$ = {students in a year group}
H = {students who study History}
G = {students who study Geography}

80 students are in the year group.
40 students study History.

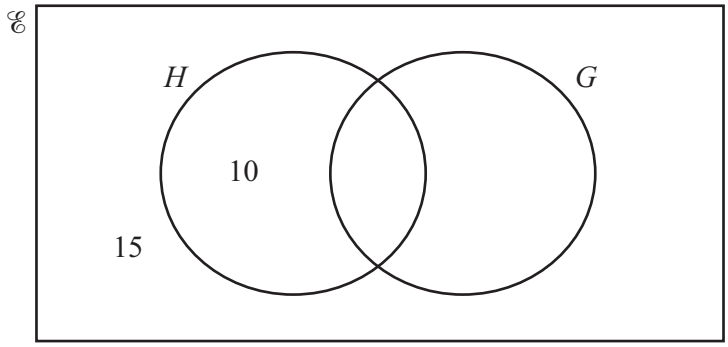

View solution

(a) Complete the Venn diagram. [2]

View solution

(b) Find n(G).

..... [1]

View solution

(c) A student is chosen at random.

Work out the probability that the student does not study History and does not study Geography.

..... [1]

View solution

25 Expand and simplify.

$$(x+3)(x-2)$$

..... [2]

View solution

26 Write 1.753×10^8 as an ordinary number.

..... [1]

27

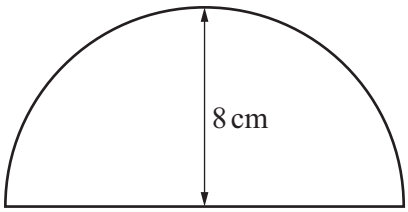

NOT TO SCALE

View solution

The diagram shows a semicircle.
The radius of the semicircle is 8 cm.

Find the perimeter of the semicircle.
Give your answer in terms of π in its simplest form.

..... cm [3]

28 Work out $8\frac{2}{3} \div 1\frac{5}{8}$.

View solution

Give your answer as a mixed number in its simplest form.

..... [3]

Question 29 is printed on the next page.

© UCLES 2025

29 Jim buys 15 apples and 10 pears for $42.50 .
Li buys 4 apples and 5 pears for $16.

View solution

Write down a pair of simultaneous equations and solve them to find the cost of one apple and the cost of one pear.

Apple $ .....

Pear $ .....
[5]

Permission to reproduce items where third-party owned material protected by copyright is included has been sought and cleared where possible. Every reasonable effort has been made by the publisher (UCLES) to trace copyright holders, but if any items requiring clearance have unwittingly been included, the publisher will be pleased to make amends at the earliest possible opportunity.

To avoid the issue of disclosure of answer-related information to candidates, all copyright acknowledgements are reproduced online in the Cambridge Assessment International Education Copyright Acknowledgements Booklet. This is produced for each series of examinations and is freely available to download at www.cambridgeinternational.org after the live examination series.

Cambridge Assessment International Education is part of Cambridge Assessment. Cambridge Assessment is the brand name of the University of Cambridge Local Examinations Syndicate (UCLES), which is a department of the University of Cambridge.

© UCLES 2025