Cambridge Assessment International Education

Cambridge IGCSE™

CANDIDATE NAME									
CENTRE NUMBER						CANDIDATE NUMBER			

MATHEMATICS **0580/13**

Paper 1 Non-calculator (Core) **October/November 2025**

1 hour 30 minutes

You must answer on the question paper.

You will need: Geometrical instruments

INSTRUCTIONS
- Answer **all** questions.
- Use a black or dark blue pen. You may use an HB pencil for any diagrams or graphs.
- Write your name, centre number and candidate number in the boxes at the top of the page.
- Write your answer to each question in the space provided.
- Do **not** use an erasable pen or correction fluid.
- Do **not** write on any bar codes.
- Calculators must **not** be used in this paper.
- You may use tracing paper.
- You must show all necessary working clearly.

INFORMATION
- The total mark for this paper is 80.
- The number of marks for each question or part question is shown in brackets [ ].

This document has **16** pages.

© UCLES 2025

List of formulas

Area, A, of triangle, base b, height h.	$A = \frac{1}{2}bh$
Area, A, of circle of radius r.	$A = \pi r^2$
Circumference, C, of circle of radius r.	$C = 2\pi r$
Curved surface area, A, of cylinder of radius r, height h.	$A = 2\pi rh$
Curved surface area, A, of cone of radius r, sloping edge l.	$A = \pi rl$
Surface area, A, of sphere of radius r.	$A = 4\pi r^2$
Volume, V, of prism, cross-sectional area A, length l.	$V = Al$
Volume, V, of pyramid, base area A, height h.	$V = \frac{1}{3}Ah$
Volume, V, of cylinder of radius r, height h.	$V = \pi r^2 h$
Volume, V, of cone of radius r, height h.	$V = \frac{1}{3}\pi r^2 h$
Volume, V, of sphere of radius r.	$V = \frac{4}{3}\pi r^3$

© UCLES 2025

Calculators must **not** be used in this paper.

1

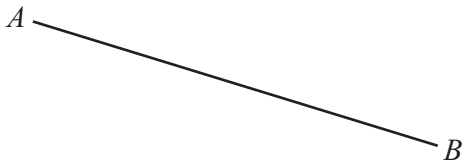

(a) Measure the length of line AB in centimetres.

View solution

..... cm [1]

View solution

(b) Draw a line that is parallel to line AB. [1]

2 **(a)** Write the number 83 042 in words.

View solution

..... [1]

(b) Write down the value of the 7 in the number 346 709.

View solution

..... [1]

(c) Write 8453 correct to

View solution

(i) the nearest hundred

..... [1]

(ii) the nearest ten.

..... [1]

View solution

3

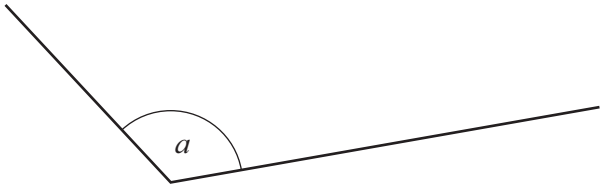

(a) Measure angle a.

View solution

..... [1]

(b) Write down the mathematical name of this type of angle.

View solution

..... [1]

4 Ben records the favourite sport of each of 20 students.

View solution

Football Cricket Hockey Rugby Football Tennis Rugby Football Football Rugby

Tennis Football Rugby Football Cricket Football Rugby Football Cricket Cricket

Complete the frequency table.
You may use the tally column to help you.

Sport	Tally	Frequency
Cricket		
Football		
Hockey		
Rugby		
Tennis		

[2]

© UCLES 2025

5 The diagram shows quadrilateral $ABCD$ on a 1 cm^2 grid.

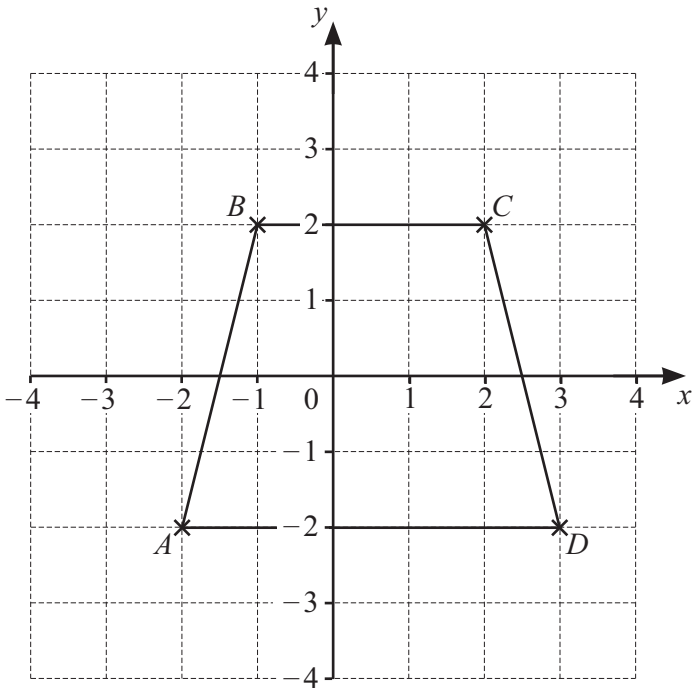

(a) Write down the coordinates of point B.

View solution

(..... , ...) [1]

(b) Write down the mathematical name of quadrilateral $ABCD$.

View solution

..... [1]

(c) Find the area of quadrilateral $ABCD$.

View solution

..... cm^2 [1]

(d) On the grid, plot the point E at (–3, 2). [1]

View solution

6 Anna thinks of a number, she multiplies it by 2 and then finds the square root. The answer is 12.

View solution

What number did Anna think of?

..... [2]

7 A journey starts at 10 55 and ends at 16 10.

View solution

Find how long the journey takes.
Give your answer in hours and minutes.

..... h ..... min [1]

8 These are the masses, in kg, of each of 11 bags.

23	16	8	10	27	19	4	17	13	4	14

View solution

(a) Complete the stem-and-leaf diagram to show this information.

0	
1	
2	

Key: 2 | 7 represents 27 kg [2]

(b) Find the median.

..... kg [1]

View solution

9 Find the value of

View solution

(a) 2^5

..... [1]

(b) 6^0.

..... [1]

View solution

10

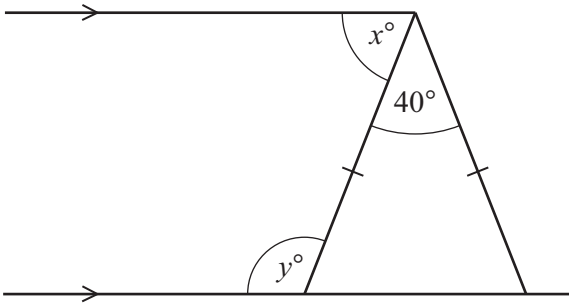

NOT TO SCALE

The diagram shows an isosceles triangle between a pair of parallel lines.

(a) Find the value of x.

View solution

$x =$ ..... [2]

(b) Find the value of y.
Give a geometrical reason for your answer.

View solution

$y =$ ..... because .....

..... [2]

11 **(a)** Sam buys 3 apples at 40 cents each.
He also buys 5 peaches.
The total cost is $3.45 .

View solution

Find the cost of 1 peach.

..... cents [3]

(b) Pears cost 55 cents each.
Bananas cost 36 cents each.

View solution

Write an expression, in cents, for the cost of x pears and y bananas.

..... [2]

© UCLES 2025

12

(a) Simplify.

View solution

$3y - 4y + 2y$

..... [1]

(b) Solve.

View solution

(i) $x + 5 = 19$

$x =$ ..... [1]

(ii) $6x - 5 = 7$

View solution

$x =$ ..... [2]

13

View solution

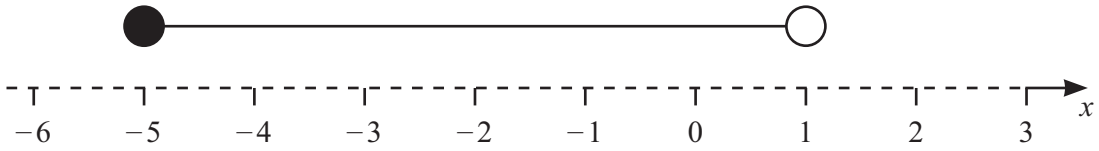

Write down the inequality represented on the number line.

..... [2]

14 Victoria invests \$2000 at a rate of 5% per year simple interest.

Calculate the value of her investment after 4 years.

View solution

\$ ..... [3]

15 Complete each statement.

(a) $0.0000047\,\text{m}^2$ = ... cm^2.

View solution

[1]

(b) $8500\,\text{cm}^3$ = ... litres.

View solution

[1]

16 Kai, Jo and Liz share some money in the ratio Kai : Jo : Liz = 4 : 7 : 13.
Jo receives \$1400.

View solution

Find the total amount of money they share.

\$ ..... [3]

17 **(a)** $k^x \times k^5 = k^{20}$

View solution

Find the value of x.

$x =$ ..... [1]

(b) Expand and simplify.

View solution

$$(x+5)(x-4)$$

..... [2]

(c) Factorise.

View solution

$$21r^3 - 7r$$

..... [2]

18 The diameter of a circle is 16 cm.

View solution

Find the area of the circle.
Leave your answer in terms of π.

..... cm^2 [2]

19 Find the number of sides of a regular polygon with interior angle 160°.

View solution

..... [2]

© UCLES 2025

20 The height, h cm, of a door is 180 cm, correct to the nearest centimetre.

Complete this statement about the value of h.

View solution

..... $\leqslant h <$ ..... [2]

21 These are the first four terms of a sequence.

$$-6 \qquad 1 \qquad 8 \qquad 15$$

(a) Write down the next term.

View solution

..... [1]

(b) Write down the term-to-term rule.

View solution

..... [1]

(c) **(i)** Find the nth term.

View solution

..... [2]

(ii) Is 688 a term in this sequence?

Explain how you decide.

View solution

..... because .....

..... [2]

22 The diagram shows triangles *A* and *B*.

View solution

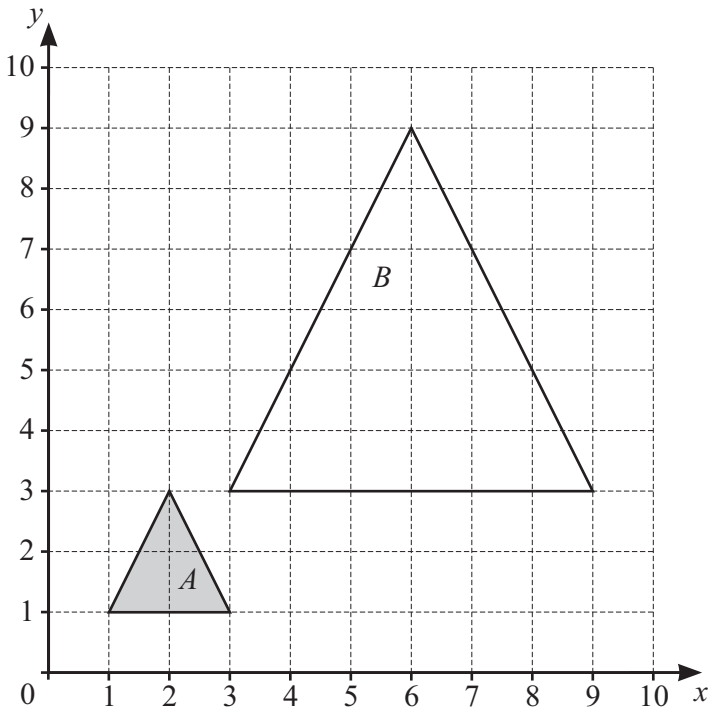

Describe fully the **single** transformation that maps triangle *A* onto triangle *B*.

.....

..... [3]

23 (a)

View solution

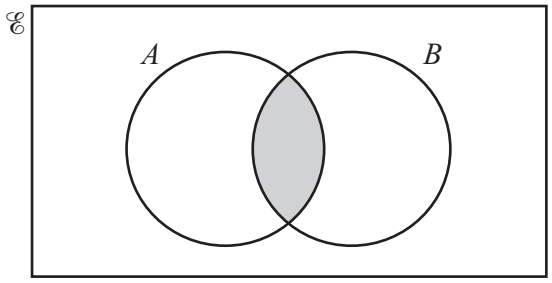

Use set notation to describe the shaded region.

..... [1]

(b)

View solution

$\mathscr{E}$ = {people in a club}
T = {people who play tennis}
S = {people who go swimming}

There are 60 people in the club.
36 people go swimming.

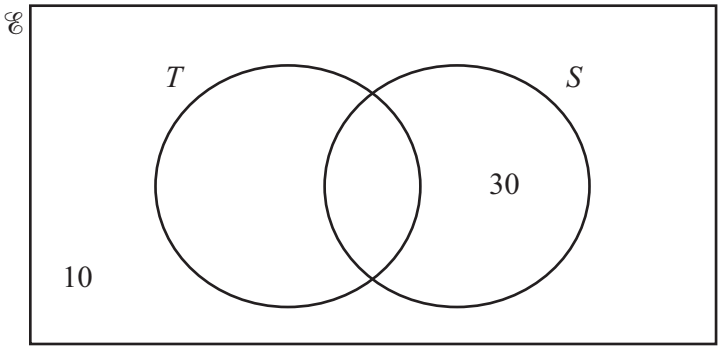

(i) Complete the Venn diagram. [2]

(ii) Find $n(T')$.

..... [1]

View solution

24 **(a)** The scale on a map is 1 cm represents 12 km.

Write this in the ratio 1 : n .

View solution

1 : ..... [1]

(b) The bearing of B from A is 070°.

Find the bearing of A from B.

View solution

..... [2]

25 Work out.

$$\frac{3}{4} \times 1\frac{2}{3}$$

Give your answer as a mixed number in its simplest form.

View solution

..... [3]

© UCLES 2025

26 There are 2 sets of traffic lights on Li's journey to work.
The probability he stops at the first set of traffic lights is 0.4 .
The probability he stops at the second set of traffic lights is 0.7 .

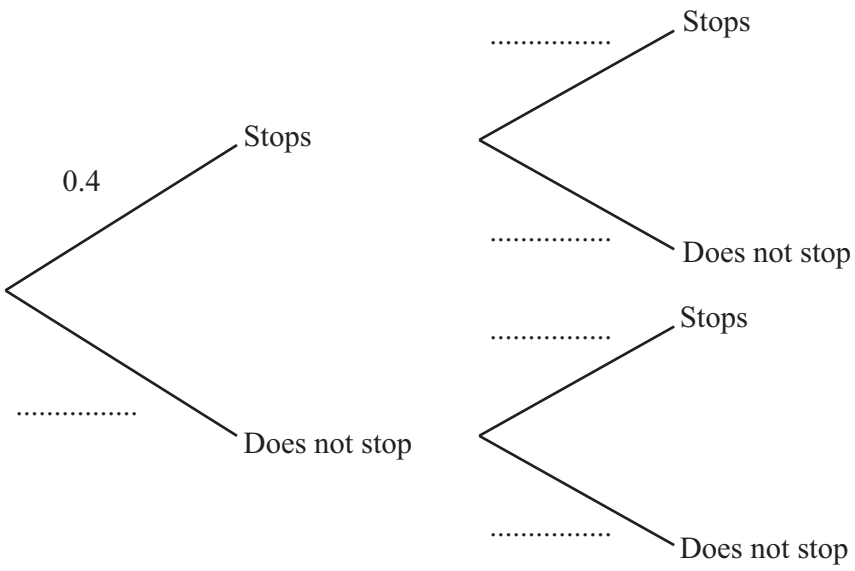

View solution

(a) Complete the tree diagram. [2]

(b) Work out the probability that Li does not stop at both sets of traffic lights.

View solution

..... [2]

Question 27 is printed on the next page.

27 Sam writes 851 000 in standard form as 85.1×10^4.

View solution

Explain why 85.1×10^4 is not a number in standard form.

.....

..... [1]

Permission to reproduce items where third-party owned material protected by copyright is included has been sought and cleared where possible. Every reasonable effort has been made by the publisher (UCLES) to trace copyright holders, but if any items requiring clearance have unwittingly been included, the publisher will be pleased to make amends at the earliest possible opportunity.

To avoid the issue of disclosure of answer-related information to candidates, all copyright acknowledgements are reproduced online in the Cambridge Assessment International Education Copyright Acknowledgements Booklet. This is produced for each series of examinations and is freely available to download at www.cambridgeinternational.org after the live examination series.

Cambridge Assessment International Education is part of Cambridge Assessment. Cambridge Assessment is the brand name of the University of Cambridge Local Examinations Syndicate (UCLES), which is a department of the University of Cambridge.

© UCLES 2025