Cambridge Assessment International Education

Cambridge IGCSE™

CANDIDATE NAME									
CENTRE NUMBER						CANDIDATE NUMBER				

MATHEMATICS **0580/22**

Paper 2 Non-calculator (Extended) **October/November 2025**

2 hours

You must answer on the question paper.

You will need: Geometrical instruments

INSTRUCTIONS
- Answer **all** questions.
- Use a black or dark blue pen. You may use an HB pencil for any diagrams or graphs.
- Write your name, centre number and candidate number in the boxes at the top of the page.
- Write your answer to each question in the space provided.
- Do **not** use an erasable pen or correction fluid.
- Do **not** write on any bar codes.
- Calculators must **not** be used in this paper.
- You may use tracing paper.
- You must show all necessary working clearly.

INFORMATION
- The total mark for this paper is 100.
- The number of marks for each question or part question is shown in brackets [ ].

This document has **16** pages.

© UCLES 2025

List of formulas

Area, A, of triangle, base b, height h.	$A = \frac{1}{2}bh$
Area, A, of circle of radius r.	$A = \pi r^2$
Circumference, C, of circle of radius r.	$C = 2\pi r$
Curved surface area, A, of cylinder of radius r, height h.	$A = 2\pi rh$
Curved surface area, A, of cone of radius r, sloping edge l.	$A = \pi rl$
Surface area, A, of sphere of radius r.	$A = 4\pi r^2$
Volume, V, of prism, cross-sectional area A, length l.	$V = Al$
Volume, V, of pyramid, base area A, height h.	$V = \frac{1}{3}Ah$
Volume, V, of cylinder of radius r, height h.	$V = \pi r^2 h$
Volume, V, of cone of radius r, height h.	$V = \frac{1}{3}\pi r^2 h$
Volume, V, of sphere of radius r.	$V = \frac{4}{3}\pi r^3$
For the equation $ax^2 + bx + c = 0$, where $a \neq 0$,	$x = \frac{-b \pm \sqrt{b^2 - 4ac}}{2a}$

For the triangle shown,

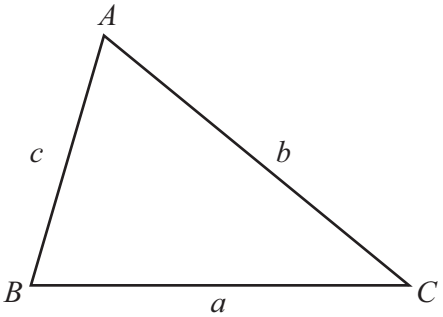

$$\frac{a}{\sin A} = \frac{b}{\sin B} = \frac{c}{\sin C}$$

$$a^2 = b^2 + c^2 - 2bc\cos A$$

$$\text{Area} = \frac{1}{2}ab\sin C$$

Calculators must **not** be used in this paper.

View solution

1 The temperature at 4 am is −12 °C.
The temperature at 4 pm is 21 °C.

Find the increase in temperature from 4 am to 4 pm.

..... °C [1]

View solution

2 Find **all** the common factors of 8 and 12.

..... [1]

View solution

3 A cuboid has length 6 cm, width 5 cm and height 2.5 cm.

Work out the volume of the cuboid.

..... cm^3 [2]

View solution

4 A computer costs $560.
In a sale, this cost is reduced by 20%.

Find the cost of the computer in the sale.

$ ..... [2]

© UCLES 2025

5 The pie chart shows some information about the way 600 students travel to school.

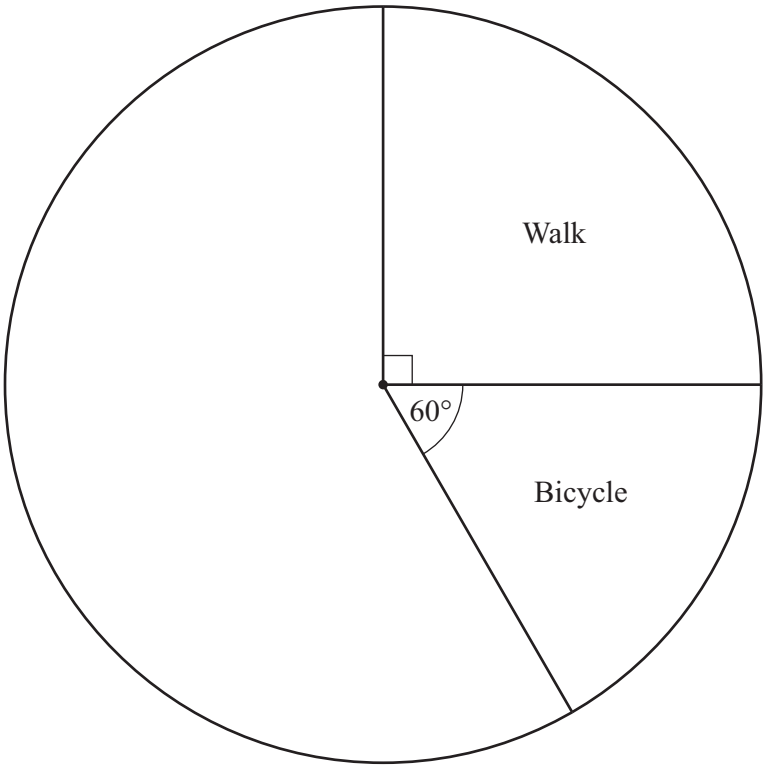

(a) Work out the number of students that walk to school.

View solution

..... [2]

(b) 120 of the students travel to school by car.
The remaining students travel by bus.

View solution

Complete the pie chart.

[3]

6

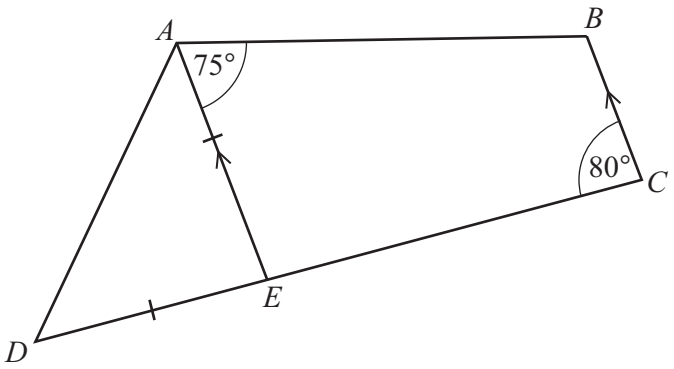

NOT TO SCALE

ABCD is a quadrilateral.
E lies on *CD* and *AE* is parallel to *BC*.
EA = *ED*.

Find

(a) angle *ABC*

View solution

Angle *ABC* = ... [1]

(b) angle *AED*

View solution

Angle *AED* = ... [1]

(c) angle *DAB*.

View solution

Angle *DAB* = ... [2]

7 Represent the inequality $-4 < x \leqslant 3$ on the number line.

View solution



[2]

© UCLES 2025

8 Kemi buys p pens that each cost 40 cents.
She pays with \$20.

View solution

Write an expression, in terms of p, for the change, in **cents**, Kemi receives from the \$20.

..... cents [2]

9 Rajid has a full bottle of juice.

View solution

He drinks $\frac{1}{3}$ of the full bottle on Monday.

He drinks $\frac{3}{7}$ of the full bottle on Tuesday.

Find the fraction of the bottle of juice remaining.

..... [3]

10 $b = dm + 2mk$

(a) $d = 3.14$, $m = 7.92$ and $k = 10.16$.

View solution

By rounding each value correct to 1 significant figure, work out an estimate for b.

..... [3]

(b) Rearrange the formula to make m the subject.

View solution

$m =$ ..... [2]

© UCLES 2025

11

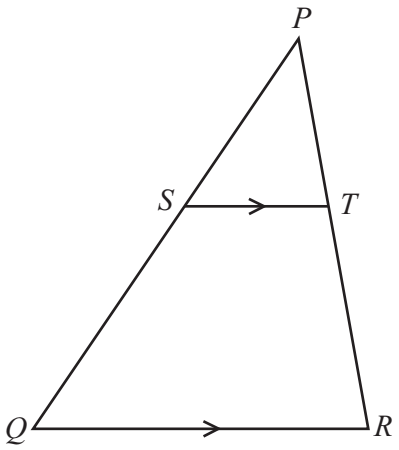

NOT TO SCALE

In the diagram, S lies on PQ and T lies on PR.
ST is parallel to QR.

(a) Explain why triangle PQR is mathematically similar to triangle PST.
Give a geometrical reason for each statement you make.

View solution

.....

.....

.....

..... [3]

(b) $ST = 3\,\text{cm}$, $QR = 9\,\text{cm}$ and $PS = 5\,\text{cm}$.

Work out PQ.

View solution

$PQ =$ .....cm [2]

(c) The area of triangle PST is $2k\,\text{cm}^2$.

Find, in terms of k, the area of quadrilateral $QRTS$.

View solution

..... cm^2 [2]

© UCLES 2025

12 A fitness club has 100 members.

60 swim (S).
70 cycle (C).
25 do not swim or cycle.

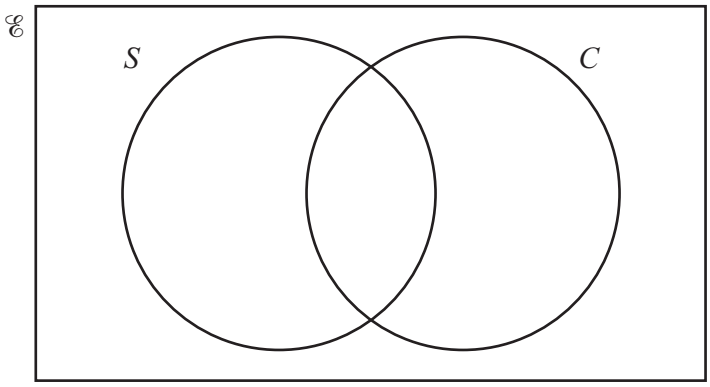

(a) Complete the Venn diagram.

View solution

[3]

(b) One member of the fitness club is chosen at random.

View solution

For this member, find

(i) P(C)

..... [1]

(ii) P($S \cap C$)

View solution

..... [1]

(iii) P($S \cup C'$).

View solution

..... [1]

13 $M = 2^7 \times 3^3 \times 5^2$

(a) Write $14M$ as a product of its prime factors.
Give your answer in index form.

View solution

..... [2]

(b) R is an integer.
$\frac{M}{R}$ is a cube number.

Find the smallest possible value of R.

View solution

$R =$ ..... [2]

14 Find the value of

(a) $3^2 \div 3^{-2}$

View solution

..... [2]

(b) $16^{-\frac{3}{2}}$.

View solution

..... [2]

© UCLES 2025

15 Factorise.

(a) $x^2 - 64$

View solution

..... [1]

(b) $5x(x-2y)+6(x-2y)^2$

View solution

..... [2]

16

View solution

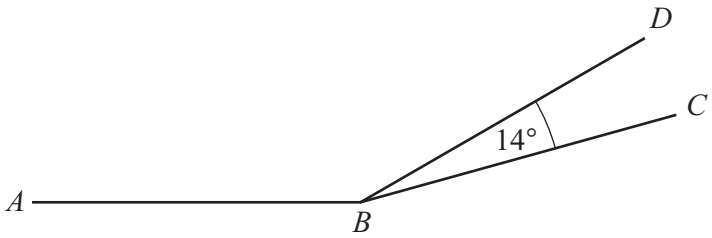

NOT TO SCALE

AB and *BD* are two sides of a regular 15-sided polygon.
AB and *BC* are two sides of a regular *n*-sided polygon.
Angle $DBC = 14°$.

Work out the value of *n*.

$n =$ ..... [4]

17 B is the point $(-3, 1)$ and D is the point $(-5, 9)$.
BD is a diagonal of the kite $ABCD$.

(a) The ratio of the lengths of the diagonals $BD : AC = 2 : 3$.

View solution

Work out the length of AC.
Give your answer as a surd in its simplest form.

..... [5]

(b) Find the coordinates of the midpoint of BD.

View solution

(..... , ...) [2]

(c) The diagonal AC of the kite passes through the midpoint of BD.

View solution

Find an equation of AC.
Give your answer in the form $y = mx + c$.

$y =$ ..... [4]

© UCLES 2025

18 Rationalise the denominator and simplify.

View solution

$$\frac{20}{4+\sqrt{6}}$$

..... [3]

19

View solution

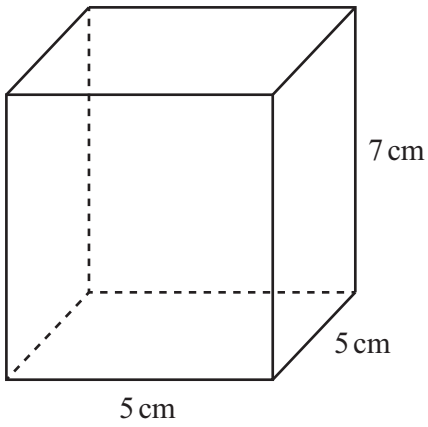

NOT TO SCALE

The diagram shows a box in the shape of a cuboid.
Mala has a straight rod of length 10 cm.

Show that this rod does **not** fit completely inside the box.

[3]

20 $f(x) = \frac{21}{2x-1}$, $x \neq \frac{1}{2}$ $g(x) = 3x+4$

View solution

(a) Find

(i) g(2)

..... [1]

(ii) gf(−1)

View solution

..... [2]

(iii) $f^{-1}(x)$.

View solution

$f^{-1}(x) =$ ..... [3]

(b) Solve $f(x) = g(x)$.

View solution

$x =$ ..... or $x =$ ..... [5]

21 (a)

View solution

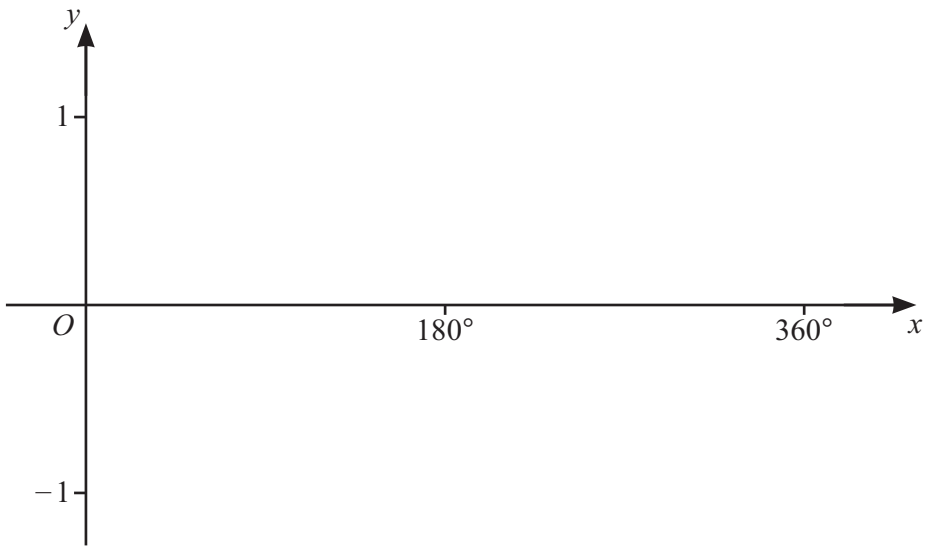

On the diagram, sketch the graph of $y = \cos x$ for $0° \leqslant x \leqslant 360°$. [2]

(b) Solve the equation $2\cos x + \sqrt{3} = 0$ for $0° \leqslant x \leqslant 360°$.

View solution

$x =$ ..... or $x =$ ..... [3]

22 A graph with equation $y = x^2 + bx + c$ has a minimum point at $(-5, 12)$.

View solution

Find the value of b and the value of c.

$b =$ .....

$c =$ .....

[3]

23

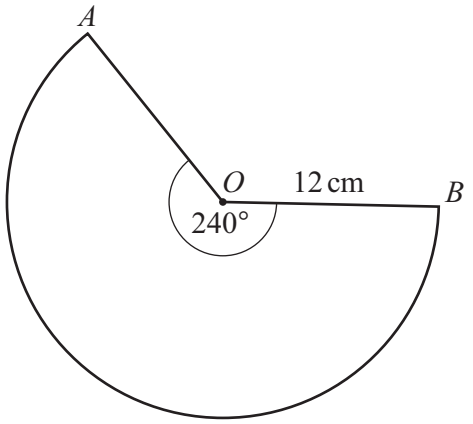

NOT TO SCALE

The diagram shows a major sector, AOB, of a circle.
The sector angle is 240° and the radius is 12 cm.

(a) Show that the length of the major arc AB is 16π cm.

View solution

[1]

(b) OA is joined to OB to form a cone.

View solution

Work out the volume of the cone.

Give your answer in the form $\frac{\left(a\sqrt{b}\right)\pi}{3}$ where a is an integer and b is a prime number.

..... cm^3 [6]

Question 24 is printed on the next page.

© UCLES 2025

24 $27^{nx} = (9^x)^2$

View solution

Find the value of n.

$n =$ ..... [2]

Permission to reproduce items where third-party owned material protected by copyright is included has been sought and cleared where possible. Every reasonable effort has been made by the publisher (UCLES) to trace copyright holders, but if any items requiring clearance have unwittingly been included, the publisher will be pleased to make amends at the earliest possible opportunity.

To avoid the issue of disclosure of answer-related information to candidates, all copyright acknowledgements are reproduced online in the Cambridge Assessment International Education Copyright Acknowledgements Booklet. This is produced for each series of examinations and is freely available to download at www.cambridgeinternational.org after the live examination series.

Cambridge Assessment International Education is part of Cambridge Assessment. Cambridge Assessment is the brand name of the University of Cambridge Local Examinations Syndicate (UCLES), which is a department of the University of Cambridge.

© UCLES 2025