Cambridge Assessment International Education

# Cambridge IGCSE™

| | | | | | | | | | |
|---|---|---|---|---|---|---|---|---|---|
| CANDIDATE NAME | | | | | | | | | |
| CENTRE NUMBER | | | | | | CANDIDATE NUMBER | | | | |

**MATHEMATICS** **0580/31**

Paper 3 Calculator (Core) **October/November 2025**

**1 hour 30 minutes**

You must answer on the question paper.

You will need: Geometrical instruments

**INSTRUCTIONS**
- Answer **all** questions.
- Use a black or dark blue pen. You may use an HB pencil for any diagrams or graphs.
- Write your name, centre number and candidate number in the boxes at the top of the page.
- Write your answer to each question in the space provided.
- Do **not** use an erasable pen or correction fluid.
- Do **not** write on any bar codes.
- You should use a scientific calculator where appropriate.
- You may use tracing paper.
- You must show all necessary working clearly.
- Give non-exact numerical answers correct to 3 significant figures, or 1 decimal place for angles in degrees, unless a different level of accuracy is specified in the question.
- For $\pi$, use either your calculator value or 3.142.

**INFORMATION**
- The total mark for this paper is 80.
- The number of marks for each question or part question is shown in brackets [ ].

This document has **16** pages.

© UCLES 2025

## List of formulas

| | |
|---|---|
| Area, $A$, of triangle, base $b$, height $h$. | $A = \frac{1}{2}bh$ |
| Area, $A$, of circle of radius $r$. | $A = \pi r^2$ |
| Circumference, $C$, of circle of radius $r$. | $C = 2\pi r$ |
| Curved surface area, $A$, of cylinder of radius $r$, height $h$. | $A = 2\pi rh$ |
| Curved surface area, $A$, of cone of radius $r$, sloping edge $l$. | $A = \pi rl$ |
| Surface area, $A$, of sphere of radius $r$. | $A = 4\pi r^2$ |
| Volume, $V$, of prism, cross-sectional area $A$, length $l$. | $V = Al$ |
| Volume, $V$, of pyramid, base area $A$, height $h$. | $V = \frac{1}{3}Ah$ |
| Volume, $V$, of cylinder of radius $r$, height $h$. | $V = \pi r^2 h$ |
| Volume, $V$, of cone of radius $r$, height $h$. | $V = \frac{1}{3}\pi r^2 h$ |
| Volume, $V$, of sphere of radius $r$. | $V = \frac{4}{3}\pi r^3$ |

© UCLES 2025

**1**

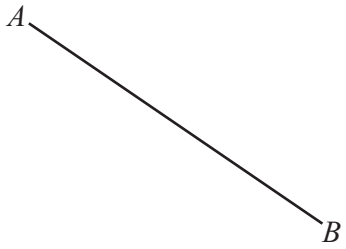


**(a)** Measure the length of line *AB* in centimetres.

View solution

..... cm [1]

**(b)** Draw a line that is perpendicular to the line *AB*.

View solution [1]

**2** Complete this shopping bill.

View solution

| | |
|---|---|
| 3.4 kg of flour at $4.60 per kg | = $ ..... |
| 2.75 kg of sugar at $ ..... per kg | = $ 9. 90 |
| | Total = $ ..... |

[3]

**3** Total cost of a journey = number of litres of fuel used × cost of fuel per litre.

View solution

A journey uses 128 litres of fuel.
The cost of fuel is $1.52 per litre.

Calculate the total cost of this journey.

$ ..... [1]

© UCLES 2025

**4** $\frac{6}{15}$ $\frac{1}{10}$ $\frac{16}{80}$ $\frac{10}{25}$ $\frac{5}{2}$

View solution

Draw a ring around the fractions which are **not** equivalent to $\frac{2}{5}$. [2]

**5** Find the value of

**(a) (i)** $\sqrt{1.96}$

View solution

..... [1]

**(ii)** $17^3$

View solution

..... [1]

**(iii)** $-0.8 \times -1.2$ .

View solution

..... [1]

**(b)** Write these numbers in order, starting with the smallest.

View solution

$\frac{11}{19}$ 58% $\frac{27}{47}$ 0.574

..... < ..... < ..... < ..... [2]

*smallest*

**6**

| | | | | | | | | |
|---|---|---|---|---|---|---|---|---|
| 17 | 4 | 25 | 18 | 14 | 6 | 3 | 18 | 12 |

Find

**(a)** the mode

View solution

..... [1]

**(b)** the range.

..... [1]

View solution

**7** A bag contains 6 red balls, 4 green balls and 2 blue balls.
Zia takes a ball from the bag at random.

The diagram shows a probability scale.

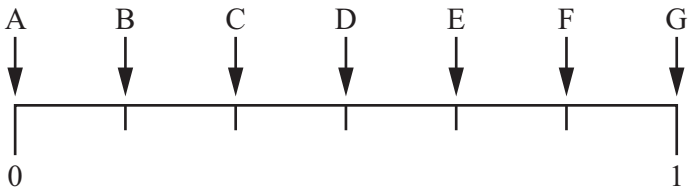


Which arrow shows the probability that,

**(a)** Zia takes a green ball

View solution

..... [1]

**(b)** Zia takes a yellow ball

View solution

..... [1]

**(c)** Zia does **not** take a blue ball.

..... [1]

**8** Solve.

**(a)** $8x = 32$

View solution

View solution

$x =$ ..... [1]

**(b)** $6x - 3 = 12$

View solution

$x =$ ..... [2]

**(c)** Represent the inequality $-4 \leqslant x < 2$ on the number line.

View solution

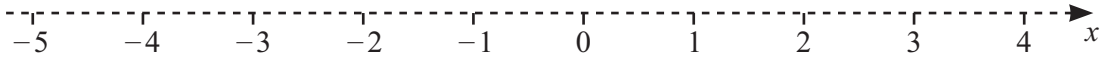


[2]

**9 (a)**

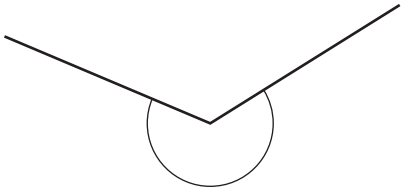

View solution

Write down the mathematical name for this type of angle.

..... [1]

**(b)** *ABC* is a triangle.

View solution

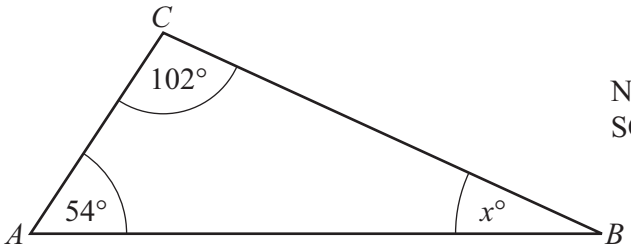


NOT TO SCALE

Lily says $x$ is 34.

Give a geometrical reason why Lily is not correct.

.....

..... [1]

**(c)**

View solution

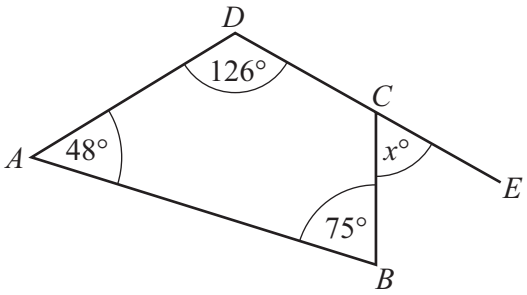


NOT TO SCALE

*ABCD* is a quadrilateral.
*DCE* is a straight line.

Calculate the value of $x$.

$x =$ ..... [2]

**10** Anna and Bruno share some money in the ratio Anna : Bruno = 3 : 7.
Bruno receives $36 more than Anna.

View solution

Calculate the total amount of money they share.

$ ..... [2]

**11** **(a)** Naz pays $76.25 per day to hire a car.
He hires this car for 7 days.
He also pays $146 for fuel.

View solution

Calculate the total amount Naz pays.

$ ..... [2]

**(b)** Li pays $1400 to hire a car.
$364 of this is insurance.

View solution

Calculate the insurance as a percentage of the $1400.

..... % [1]

**12** 300 students choose where to go on a trip.
The students choose either a zoo, a museum, an art gallery or a sports stadium.

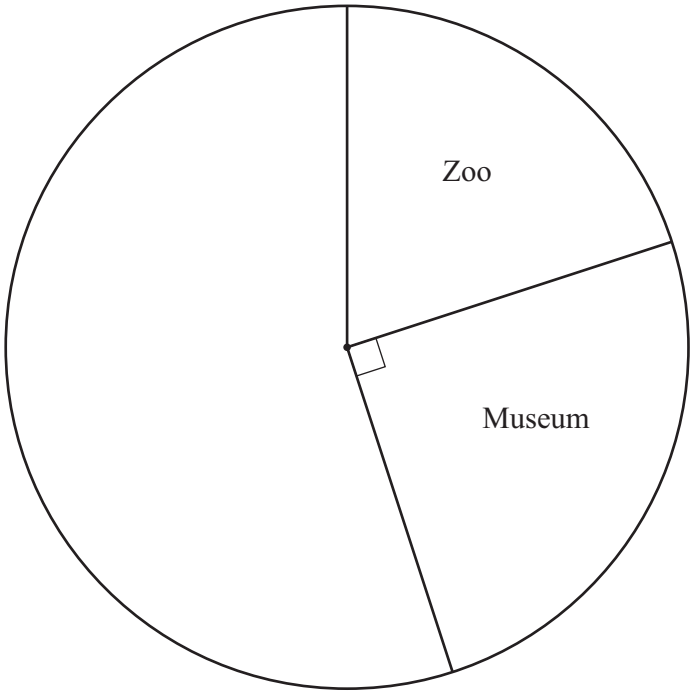


**(a)** Show that 75 students choose the museum.

View solution

[1]

**(b)** 45 students choose the art gallery and 120 students choose the sports stadium.

Complete the pie chart to show this information. [2]

View solution

**13** **(a)** The surface area of a solid cube is $121.5\,\text{cm}^2$.

Calculate the length of the side of the cube.

View solution

..... cm [3]

**(b)**

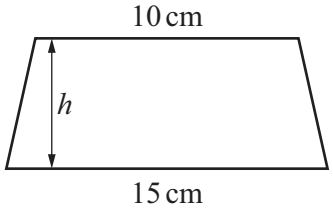


NOT TO SCALE

View solution

The area of the trapezium is $106.25\,\text{cm}^2$.

**(i)** Calculate the height of the trapezium.

..... cm [2]

**(ii)** Convert $106.25\,\text{cm}^2$ into $\text{m}^2$.

View solution

..... $\text{m}^2$ [1]

**14** A bag contains red, yellow, blue and green cards.
The table shows the probability of taking a red card and a yellow card.
The probability of taking a blue card or a green card is in the ratio blue : green = 5 : 2 .

View solution

Complete the table.

| Colour | red | yellow | blue | green |
|---|---|---|---|---|
| Probability | 0.53 | 0.19 | | |

[3]

**15** Shapes $A$ and $B$ are shown on the grid.

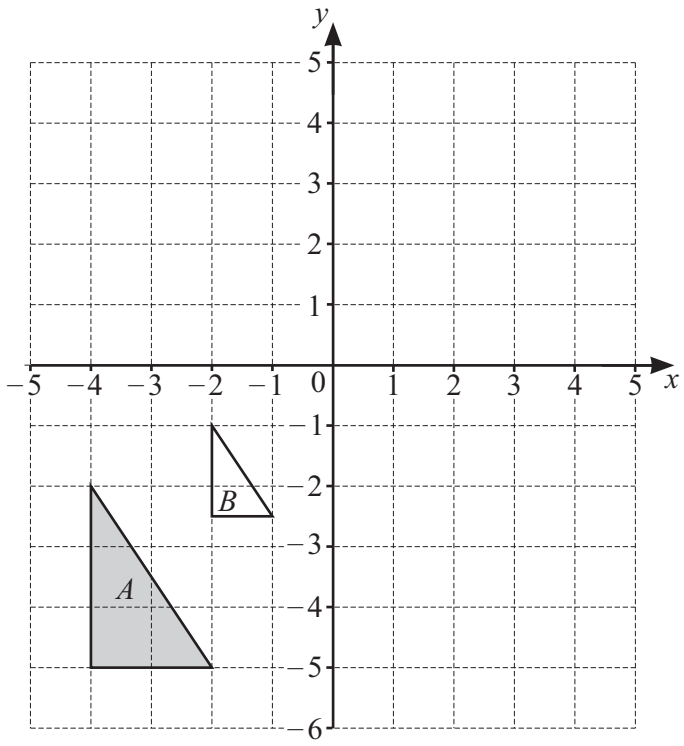


**(a)** Describe fully the **single** transformation that maps shape $A$ onto shape $B$.

View solution

.....

..... [3]

**(b)** On the grid, draw the image of shape $A$ after a translation by the vector $\begin{pmatrix} 6 \\ 7 \end{pmatrix}$. [2]

View solution

**16** Bob travels from town *A* to town *B*.
The travel graph shows his journey.

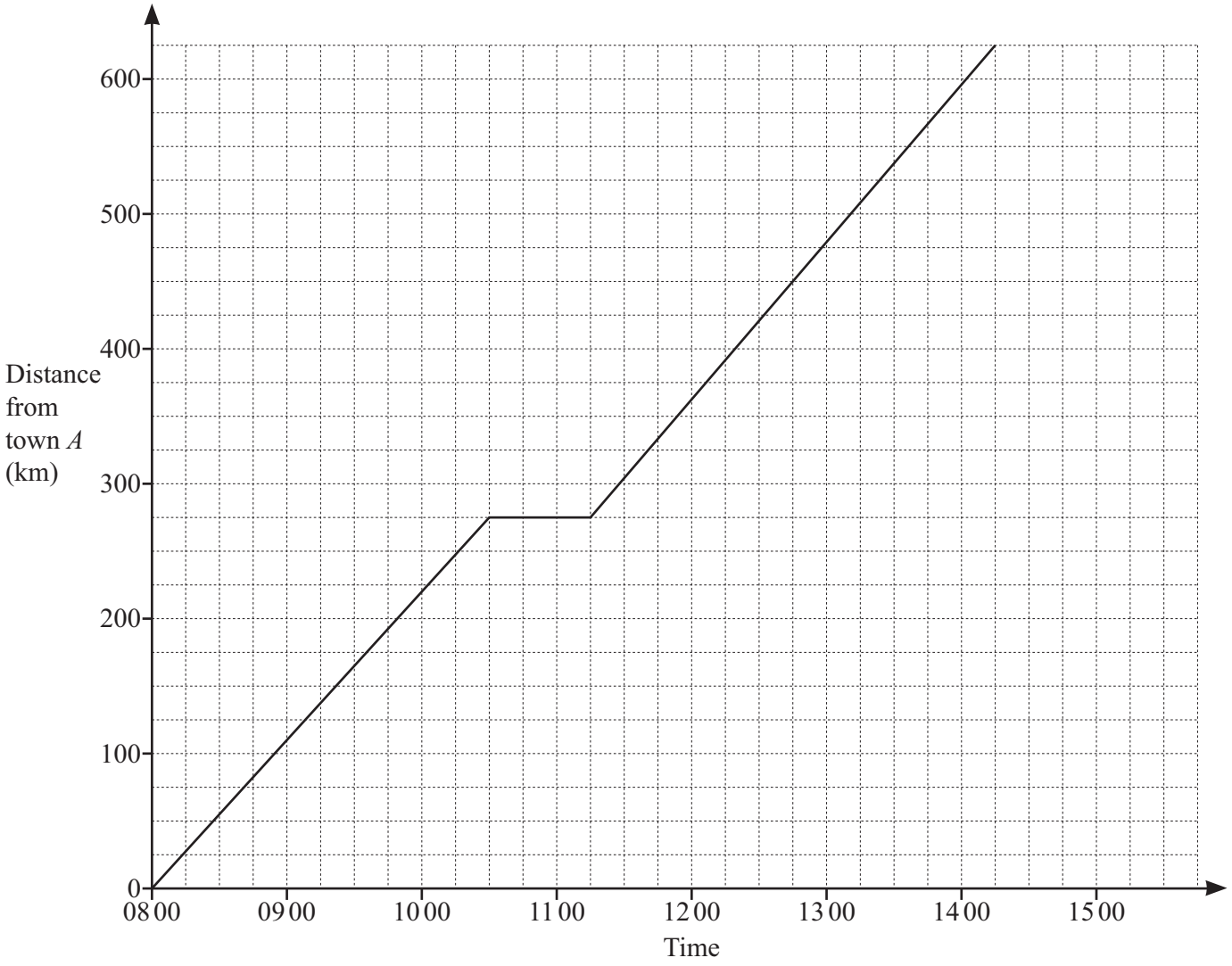


**(a)** Between which two times did Bob stop for a rest?
Explain how you know.

..... and ..... because .....

..... [2]

**(b)** Calculate Bob's average speed, in km/h, for the whole journey.

..... km/h [3]

**17** Factorise.

View solution

$21x - 7xy$

..... [2]

**18** **(a)** The $n$th term of a sequence is $n^2 - 4$.

View solution

Find the first 3 terms of this sequence.

....., ....., ..... [2]

**(b)** These are the first four terms of a different sequence.

View solution

5 2 −1 −4

Find the $n$th term.

..... [2]

**19** Jo invests \$500 at a rate of 2% per year compound interest.

View solution

Calculate the amount of interest earned at the end of 7 years.

\$ ..... [3]

**20** **(a)** Work out the size of one interior angle of a regular 8-sided polygon.

View solution

..... [2]

**(b)**

View solution

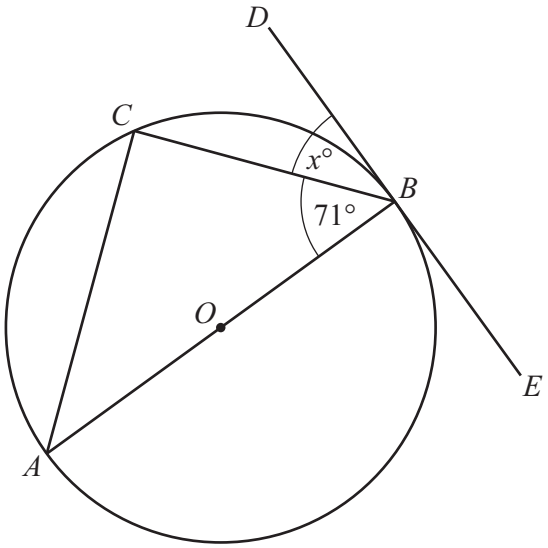


NOT TO SCALE

$A$, $B$ and $C$ lie on the circumference of the circle, centre $O$.
$AB$ is a diameter.
$DBE$ is a tangent to the circle at $B$.

Find the value of $x$.
Give a geometrical reason for your answer.

..... because .....

..... [2]

**21** The line $L$ is shown on the grid.

View solution

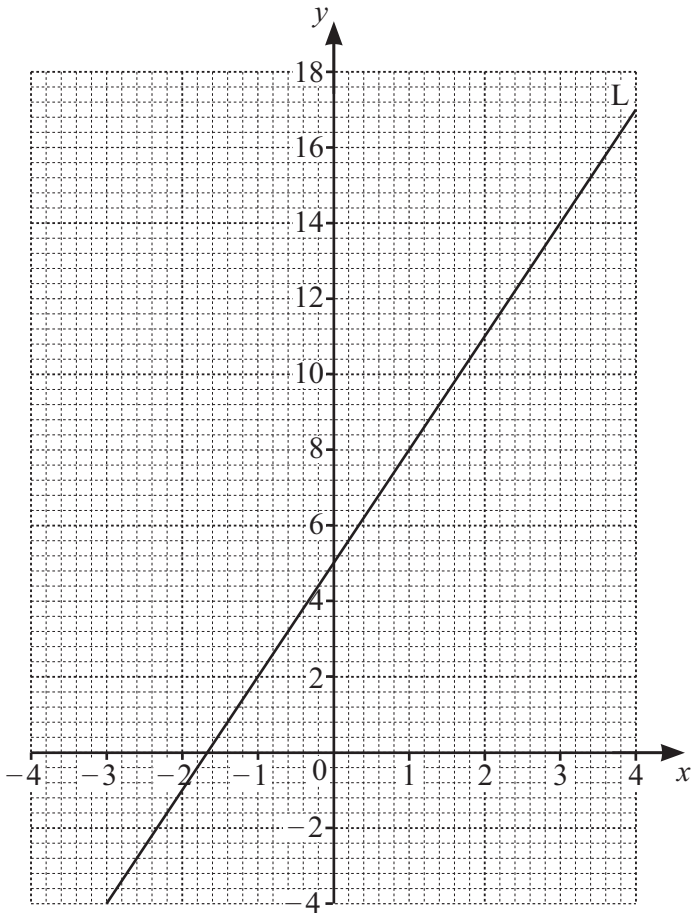


Find the equation of the line $L$.

Give your answer in the form $y = mx + c$.

$y =$ ..... [3]

**22** **(a)** A train to town $P$ leaves a station every 20 minutes.
A train to town $Q$ leaves the same station every 35 minutes.
Both trains leave at 09 30.

View solution

Find the next time both trains leave together.

..... [3]

**(b)** The distance, $d$ km, between town $P$ and town $Q$ is 97 km, correct to the nearest kilometre.

View solution

Complete the statement about the value of $d$.

..... $\leqslant d <$ ..... [2]

**23** Calculate $\dfrac{4.6 \times 10^3}{1.84 \times 10^5}$.

View solution

Give your answer in standard form.

..... [2]

**Question 24 is printed on the next page**

**24**

View solution

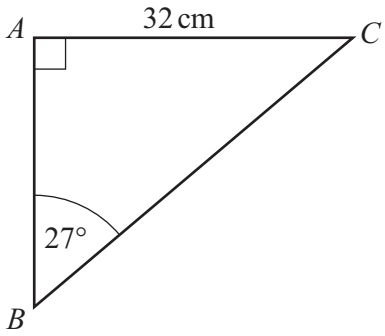


NOT TO SCALE

*ABC* is a right-angled triangle.

Calculate *BC*.

*BC* = ..... cm [3]

Permission to reproduce items where third-party owned material protected by copyright is included has been sought and cleared where possible. Every reasonable effort has been made by the publisher (UCLES) to trace copyright holders, but if any items requiring clearance have unwittingly been included, the publisher will be pleased to make amends at the earliest possible opportunity.

To avoid the issue of disclosure of answer-related information to candidates, all copyright acknowledgements are reproduced online in the Cambridge Assessment International Education Copyright Acknowledgements Booklet. This is produced for each series of examinations and is freely available to download at www.cambridgeinternational.org after the live examination series.

Cambridge Assessment International Education is part of Cambridge Assessment. Cambridge Assessment is the brand name of the University of Cambridge Local Examinations Syndicate (UCLES), which is a department of the University of Cambridge.

© UCLES 2025