Cambridge IGCSE

Cambridge International Examinations
Cambridge International General Certificate of Secondary Education

CANDIDATE NAME									
CENTRE NUMBER						CANDIDATE NUMBER				

ADDITIONAL MATHEMATICS **0606/21**

Paper 2 **May/June 2015**

2 hours

Candidates answer on the Question Paper.

Additional Materials: Electronic calculator

READ THESE INSTRUCTIONS FIRST

Write your Centre number, candidate number and name on all the work you hand in.
Write in dark blue or black pen.
You may use an HB pencil for any diagrams or graphs.
Do not use staples, paper clips, glue or correction fluid.
DO **NOT** WRITE IN ANY BARCODES.

Answer **all** the questions.
Give non-exact numerical answers correct to 3 significant figures, or 1 decimal place in the case of angles in degrees, unless a different level of accuracy is specified in the question.
The use of an electronic calculator is expected, where appropriate.
You are reminded of the need for clear presentation in your answers.

At the end of the examination, fasten all your work securely together.
The number of marks is given in brackets [ ] at the end of each question or part question.
The total number of marks for this paper is 80.

This document consists of **15** printed pages and **1** blank page.

© UCLES 2015

CAMBRIDGE International Examinations

Mathematical Formulae

1. ALGEBRA

Quadratic Equation

For the equation $ax^2 + bx + c = 0$,

$$x = \frac{-b \pm \sqrt{b^2 - 4ac}}{2a}$$

Binomial Theorem

$$(a + b)^n = a^n + \binom{n}{1} a^{n-1} b + \binom{n}{2} a^{n-2} b^2 + \ldots + \binom{n}{r} a^{n-r} b^r + \ldots + b^n,$$

where n is a positive integer and $\binom{n}{r} = \frac{n!}{(n-r)!r!}$

2. TRIGONOMETRY

Identities

$$\sin^2 A + \cos^2 A = 1$$

$$\sec^2 A = 1 + \tan^2 A$$

$$\operatorname{cosec}^2 A = 1 + \cot^2 A$$

Formulae for ΔABC

$$\frac{a}{\sin A} = \frac{b}{\sin B} = \frac{c}{\sin C}$$

$$a^2 = b^2 + c^2 - 2bc \cos A$$

$$\Delta = \frac{1}{2} bc \sin A$$

© UCLES 2015

1 **(a)** Write $\log_{27} x$ as a logarithm to base 3. [2]

View solution

(b) Given that $\log_a y = 3(\log_a 15 - \log_a 3) + 1$, express y in terms of a. [3]

View solution

2 (a)

View solution

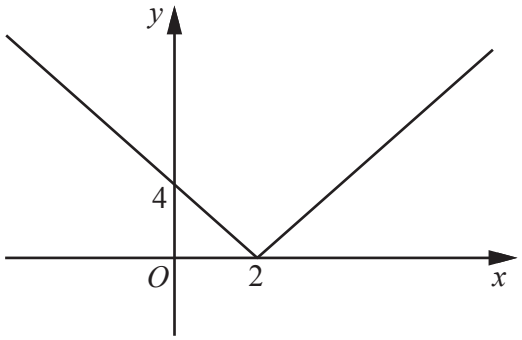

The diagram shows the graph of $y = |f(x)|$ passing through $(0, 4)$ and touching the x-axis at $(2, 0)$. Given that the graph of $y = f(x)$ is a straight line, write down the two possible expressions for $f(x)$. [2]

(b) On the axes below, sketch the graph of $y = e^{-x} + 3$, stating the coordinates of any point of intersection with the coordinate axes. [3]

View solution

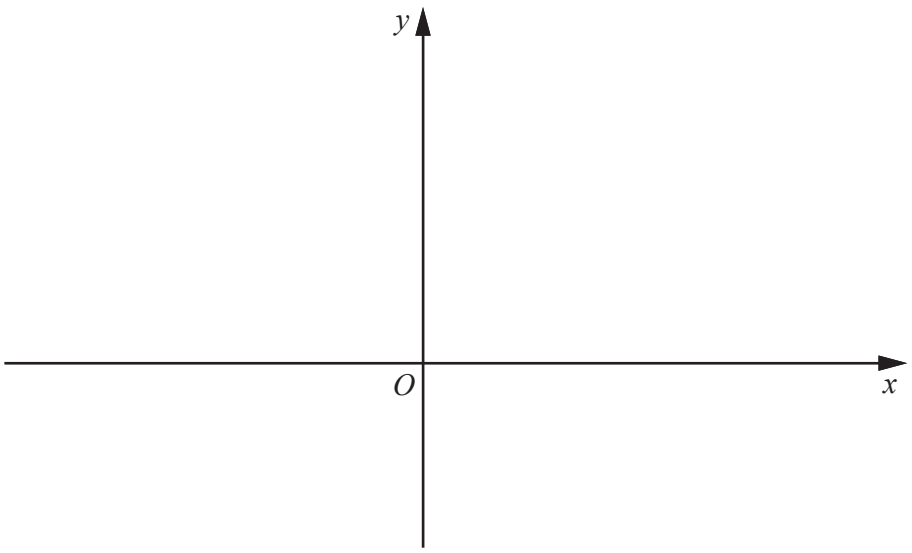

3 **(a)** Find the matrix $\mathbf{A}$ if $4\mathbf{A} + 5\begin{pmatrix} 4 & 0 & -1 \\ 3 & -2 & 5 \end{pmatrix} = \begin{pmatrix} 52 & -8 & 19 \\ 31 & 2 & 65 \end{pmatrix}$. [2]

View solution

(b) $\mathbf{P} = \begin{pmatrix} 30 & 25 & 65 \\ 70 & 15 & 80 \\ 50 & 40 & 30 \\ 40 & 20 & 75 \end{pmatrix}$ $\mathbf{Q} = (650 \quad 500 \quad 450 \quad 225)$

View solution

The matrix $\mathbf{P}$ represents the number of 4 different televisions that are on sale in each of 3 shops. The matrix $\mathbf{Q}$ represents the value of each television in dollars.

(i) State, without evaluation, what is represented by the matrix $\mathbf{QP}$. [1]

(ii) Given that the matrix $\mathbf{R} = \begin{pmatrix} 1 \\ 1 \\ 1 \end{pmatrix}$, state, without evaluation, what is represented by the matrix $\mathbf{QPR}$. [1]

View solution

© UCLES 2015

4

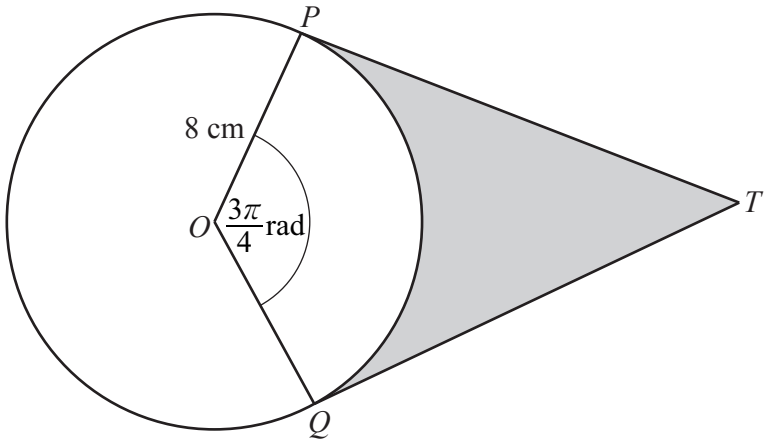

The diagram shows a circle, centre O, radius 8 cm. The points P and Q lie on the circle. The lines PT and QT are tangents to the circle and angle $POQ = \frac{3\pi}{4}$ radians.

(i) Find the length of PT. [2]

View solution

(ii) Find the area of the shaded region. [3]

View solution

(iii) Find the perimeter of the shaded region. [2]

View solution

© UCLES 2015

5 **(a)** A lock can be opened using only the number 4351. State whether this is a permutation or a combination of digits, giving a reason for your answer. [1]

View solution

(b) There are twenty numbered balls in a bag. Two of the balls are numbered 0, six are numbered 1, five are numbered 2 and seven are numbered 3, as shown in the table below.

View solution

Number on ball	0	1	2	3
Frequency	2	6	5	7

Four of these balls are chosen at random, without replacement. Calculate the number of ways this can be done so that

(i) the four balls all have the same number, [2]

(ii) the four balls all have different numbers, [2]

View solution

(iii) the four balls have numbers that total 3. [3]

View solution

6 A particle P is projected from the origin O so that it moves in a straight line. At time t seconds after projection, the velocity of the particle, v ms^{-1}, is given by $v = 2t^2 - 14t + 12$.

(i) Find the time at which P first comes to instantaneous rest. [2]

View solution

(ii) Find an expression for the displacement of P from O at time t seconds. [3]

View solution

(iii) Find the acceleration of P when $t = 3$. [2]

View solution

7 **(a)** The four points O, A, B and C are such that

$$\overrightarrow{OA} = 5\mathbf{a}, \qquad \overrightarrow{OB} = 15\mathbf{b}, \qquad \overrightarrow{OC} = 24\mathbf{b} - 3\mathbf{a}.$$

View solution

Show that B lies on the line AC. [3]

(b) Relative to an origin O, the position vector of the point P is $\mathbf{i} - 4\mathbf{j}$ and the position vector of the point Q is $3\mathbf{i} + 7\mathbf{j}$. Find

(i) $|\overrightarrow{PQ}|$, [2]

View solution

(ii) the unit vector in the direction $\overrightarrow{PQ}$, [1]

View solution

(iii) the position vector of M, the mid-point of PQ. [2]

View solution

© UCLES 2015

8 **(a)** **(i)** Find $\int e^{4x+3} dx$. [2]

View solution

(ii) Hence evaluate $\int_{2.5}^{3} e^{4x+3} dx$. [2]

View solution

(b) **(i)** Find $\int \cos\left(\frac{x}{3}\right) dx$. [2]

View solution

(ii) Hence evaluate $\int_{0}^{\frac{\pi}{6}} \cos\left(\frac{x}{3}\right) dx$. [2]

View solution

© UCLES 2015

(c) Find $\int (x^{-1} + x)^2 \, \mathrm{d}x$. [4]

View solution

9 **(a)** Find the set of values of x for which $4x^2 + 19x - 5 \leqslant 0$. [3]

View solution

(b) **(i)** Express $x^2 + 8x - 9$ in the form $(x + a)^2 + b$, where a and b are integers. [2]

View solution

(ii) Use your answer to part **(i)** to find the greatest value of $9 - 8x - x^2$ and the value of x at which this occurs. [2]

View solution

© UCLES 2015

(iii) Sketch the graph of $y = 9 - 8x - x^2$, indicating the coordinates of any points of intersection with the coordinate axes. [2]

View solution

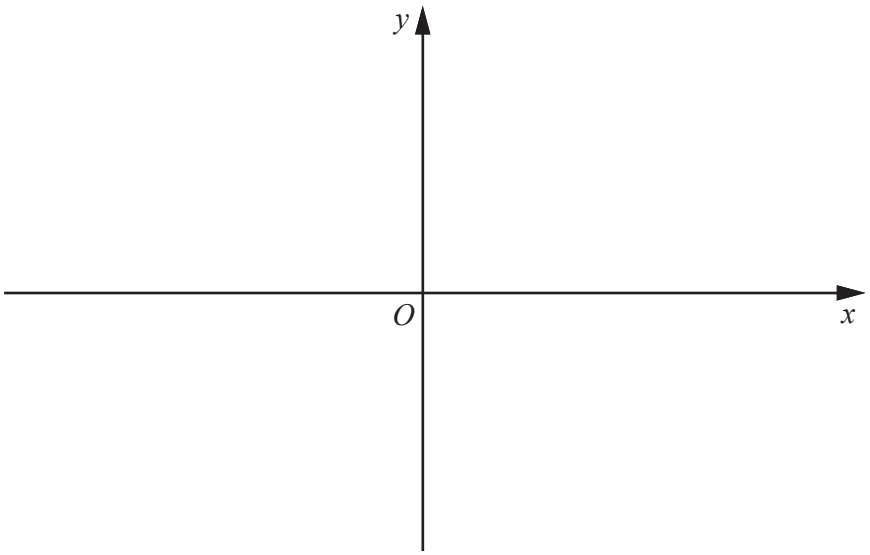

10 The relationship between experimental values of two variables, x and y, is given by $y = Ab^x$, where A and b are constants.

(i) By transforming the relationship $y = Ab^x$, show that plotting $\ln y$ against x should produce a straight line graph. [2]

View solution

(ii) The diagram below shows the results of plotting $\ln y$ against x for 7 different pairs of values of variables, x and y. A line of best fit has been drawn.

View solution

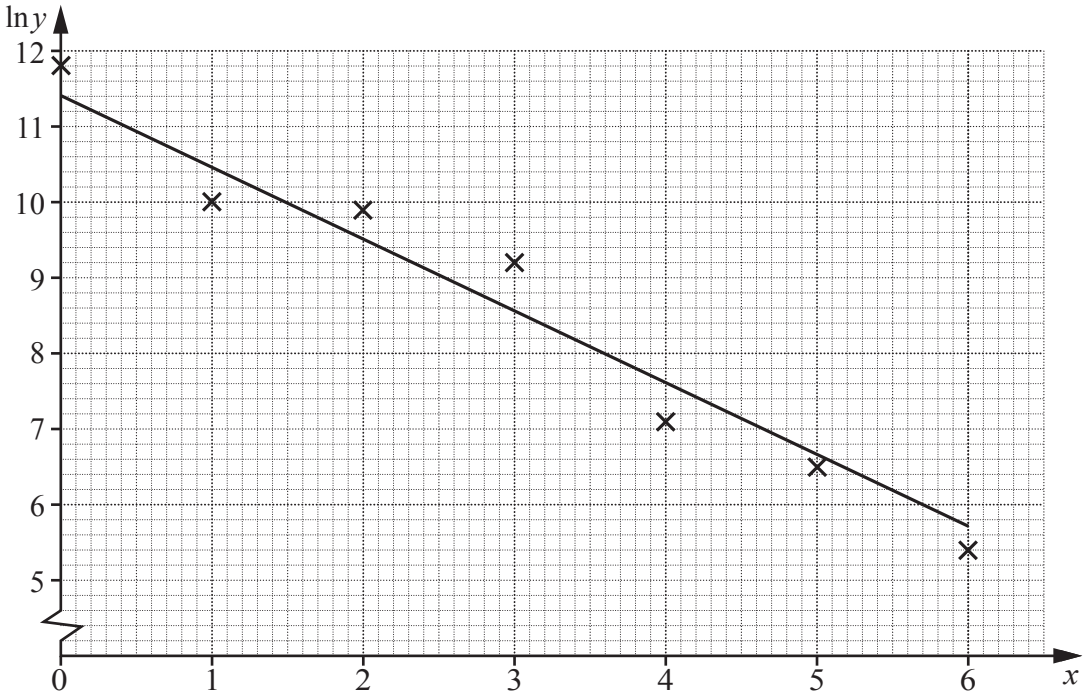

By taking readings from the diagram, find the value of A and of b, giving each value correct to 1 significant figure. [4]

(iii) Estimate the value of y when $x = 2.5$. [2]

View solution

11

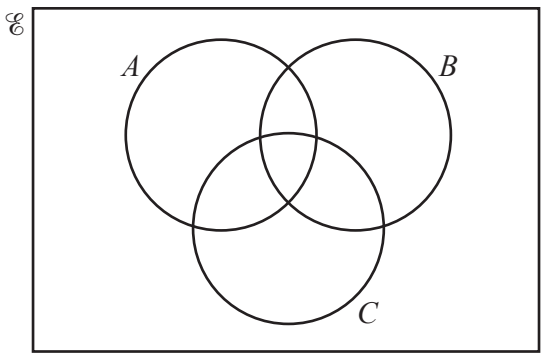

The Venn diagram above shows the sets A, B and C. It is given that
$\mathrm{n}(A \cup B \cup C) = 48$,
$\mathrm{n}(A) = 30$, $\mathrm{n}(B) = 25$, $\mathrm{n}(C) = 15$,
$\mathrm{n}(A \cap B) = 7$, $\mathrm{n}(B \cap C) = 6$, $\mathrm{n}(A' \cap B \cap C') = 16$.

(i) Find the value of x, where $x = \mathrm{n}(A \cap B \cap C)$. [3]

View solution

(ii) Find the value of y, where $y = \mathrm{n}(A \cap B' \cap C)$. [3]

View solution

(iii) Hence show that $A' \cap B' \cap C = \varnothing$. [1]

View solution

© UCLES 2015

BLANK PAGE

Permission to reproduce items where third-party owned material protected by copyright is included has been sought and cleared where possible. Every reasonable effort has been made by the publisher (UCLES) to trace copyright holders, but if any items requiring clearance have unwittingly been included, the publisher will be pleased to make amends at the earliest possible opportunity.

To avoid the issue of disclosure of answer-related information to candidates, all copyright acknowledgements are reproduced online in the Cambridge International Examinations Copyright Acknowledgements Booklet. This is produced for each series of examinations and is freely available to download at www.cie.org.uk after the live examination series.

Cambridge International Examinations is part of the Cambridge Assessment Group. Cambridge Assessment is the brand name of University of Cambridge Local Examinations Syndicate (UCLES), which is itself a department of the University of Cambridge.

© UCLES 2015