Cambridge IGCSE

Cambridge International Examinations
Cambridge International General Certificate of Secondary Education

CANDIDATE NAME	
CENTRE NUMBER	
CANDIDATE NUMBER	

ADDITIONAL MATHEMATICS **0606/13**

Paper 1 **May/June 2017**

2 hours

Candidates answer on the Question Paper.

Additional Materials: Electronic calculator

READ THESE INSTRUCTIONS FIRST

Write your Centre number, candidate number and name on all the work you hand in.
Write in dark blue or black pen.
You may use an HB pencil for any diagrams or graphs.
Do not use staples, paper clips, glue or correction fluid.
DO **NOT** WRITE IN ANY BARCODES.

Answer **all** the questions.
Give non-exact numerical answers correct to 3 significant figures, or 1 decimal place in the case of angles in degrees, unless a different level of accuracy is specified in the question.
The use of an electronic calculator is expected, where appropriate.
You are reminded of the need for clear presentation in your answers.

At the end of the examination, fasten all your work securely together.
The number of marks is given in brackets [ ] at the end of each question or part question.
The total number of marks for this paper is 80.

This document consists of **15** printed pages and **1** blank page.

© UCLES 2017

Mathematical Formulae

1. ALGEBRA

Quadratic Equation

For the equation $ax^2 + bx + c = 0$,

$$x = \frac{-b \pm \sqrt{b^2 - 4ac}}{2a}$$

Binomial Theorem

$$(a + b)^n = a^n + \binom{n}{1} a^{n-1} b + \binom{n}{2} a^{n-2} b^2 + \ldots + \binom{n}{r} a^{n-r} b^r + \ldots + b^n,$$

where n is a positive integer and $\binom{n}{r} = \frac{n!}{(n-r)!r!}$

2. TRIGONOMETRY

Identities

$$\sin^2 A + \cos^2 A = 1$$

$$\sec^2 A = 1 + \tan^2 A$$

$$\operatorname{cosec}^2 A = 1 + \cot^2 A$$

Formulae for ΔABC

$$\frac{a}{\sin A} = \frac{b}{\sin B} = \frac{c}{\sin C}$$

$$a^2 = b^2 + c^2 - 2bc \cos A$$

$$\Delta = \frac{1}{2} bc \sin A$$

© UCLES 2017

1 **(a)** On the Venn diagram below, shade the region which represents $(A \cap B') \cup (C \cap B')$. [1]

View solution

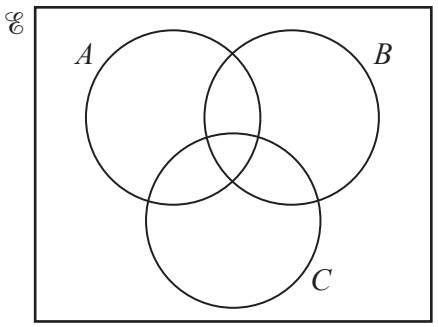

(b) Complete the Venn diagram below to show the sets Y and Z such that $Z \subset X \subset Y$. [1]

View solution

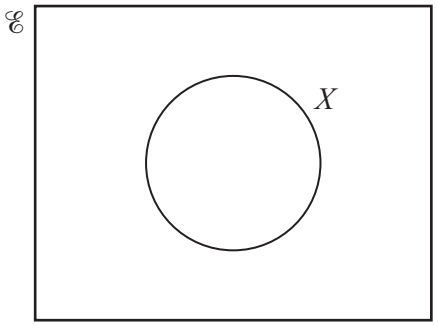

2 Given that $y = 3 + 4\cos 9x$, write down

(i) the amplitude of y, [1]

View solution

(ii) the period of y. [1]

View solution

3 **(i)** On the axes below, sketch the graph of $y = 3\sin x - 2$ for $0^\circ \leqslant \theta \leqslant 360^\circ$. [3]

View solution

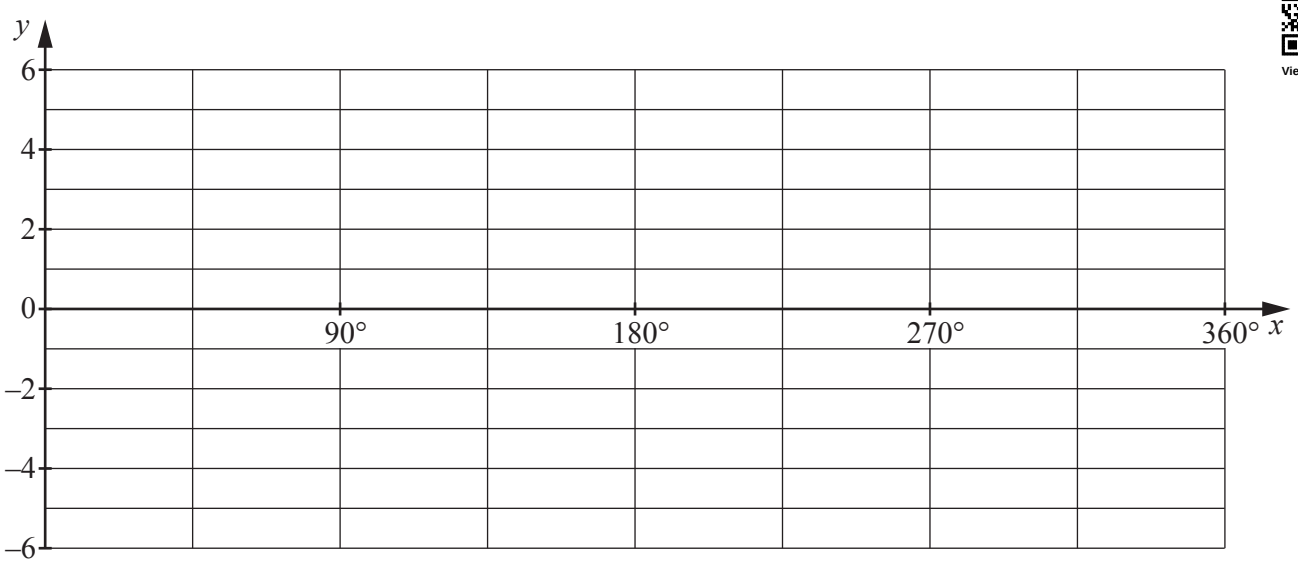

(ii) Given that $0 \leqslant |3\sin x - 2| \leqslant k$ for $0^\circ \leqslant x \leqslant 360^\circ$, write down the value of k. [1]

View solution

4 In this question, all dimensions are in centimetres.

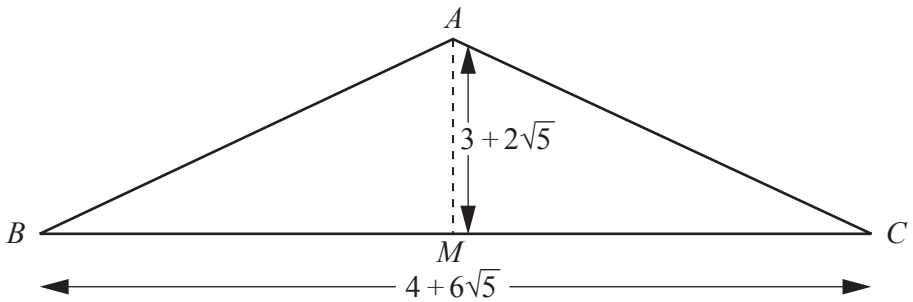

The diagram shows an isosceles triangle ABC, where $AB = AC$. The point M is the mid-point of BC. Given that $AM = 3 + 2\sqrt{5}$ and $BC = 4 + 6\sqrt{5}$, find, **without using a calculator**,

(i) the area of triangle ABC, [2]

View solution

(ii) tan ABC, giving your answer in the form $\frac{a + b\sqrt{5}}{c}$ where a, b and c are positive integers. [3]

View solution

© UCLES 2017

5 The normal to the curve $y = \sqrt{4x + 9}$, at the point where $x = 4$, meets the x- and y-axes at the points A and B. Find the coordinates of the mid-point of the line AB. [7]

View solution

© UCLES 2017

6 **(a)** Given that $\mathbf{A} = \begin{pmatrix} 3 & 1 \\ 2 & 4 \end{pmatrix}$, $\mathbf{B} = \begin{pmatrix} 5 & 1 \\ 2 & 4 \\ -1 & 0 \end{pmatrix}$ and $\mathbf{C} = \begin{pmatrix} -5 & 2 \\ 3 & 1 \end{pmatrix}$, find

View solution

(i) $\mathbf{A} + 3\mathbf{C}$, [2]

(ii) $\mathbf{BA}$. [2]

View solution

(b) **(i)** Given that $\mathbf{X} = \begin{pmatrix} 1 & -3 \\ 4 & -2 \end{pmatrix}$, find $\mathbf{X}^{-1}$. [2]

View solution

(ii) Hence find $\mathbf{Y}$, such that $\mathbf{XY} = \begin{pmatrix} 5 & -10 \\ 15 & 20 \end{pmatrix}$. [3]

View solution

© UCLES 2017

7 **(a)** Show that $\dfrac{\tan^2\theta + \sin^2\theta}{\cos\theta + \sec\theta} = \tan\theta\sin\theta$. [4]

View solution

(b) Given that $x = 3\sin\phi$ and $y = \dfrac{3}{\cos\phi}$, find the numerical value of $9y^2 - x^2y^2$. [3]

View solution

8 It is given that $\mathrm{p}(x) = 2x^3 + ax^2 + 4x + b$, where a and b are constants. It is given also that $2x + 1$ is a factor of $\mathrm{p}(x)$ and that when $\mathrm{p}(x)$ is divided by $x - 1$ there is a remainder of -12.

(i) Find the value of a and of b. [5]

View solution

(ii) Using your values of a and b, write $\mathrm{p}(x)$ in the form $(2x + 1)\mathrm{q}(x)$, where $\mathrm{q}(x)$ is a quadratic expression. [2]

View solution

(iii) Hence find the exact solutions of the equation $\mathrm{p}(x) = 0$. [2]

View solution

9 It is given that $\int_{-k}^{k}(15e^{5x}-5e^{-5x})dx = 6$.

(i) Show that $e^{5k}-e^{-5k}=3$. [5]

View solution

(ii) Hence, using the substitution $y = e^{5k}$, or otherwise, find the value of k. [3]

View solution

10 It is given that $y = (10x + 2)\ln(5x + 1)$.

(i) Find $\frac{dy}{dx}$. [4]

View solution

(ii) Hence show that $\int \ln(5x + 1)\,dx = \frac{(ax + b)}{5}\ln(5x + 1) - x + c$, where a and b are integers and c is a constant of integration. [3]

View solution

(iii) Hence find $\int_0^{\frac{1}{5}} \ln(5x+1)\,\mathrm{d}x$, giving your answer in the form $\frac{d+\ln f}{5}$, where d and f are integers. [2]

View solution

11 A curve has equation $y = 6x - x\sqrt{x}$.

(i) Find the coordinates of the stationary point of the curve. [4]

View solution

(ii) Determine the nature of this stationary point. [2]

View solution

(iii) Find the approximate change in y when x increases from 4 to $4 + h$, where h is small. [3]

View solution

© UCLES 2017

12 A particle moves in a straight line, such that its velocity, v ms^{-1}, t s after passing a fixed point O, is given by $v = 2 + 6t + 3\sin 2t$.

(i) Find the acceleration of the particle at time t. [2]

View solution

(ii) Hence find the smallest value of t for which the acceleration of the particle is zero. [2]

View solution

(iii) Find the displacement, x m from O, of the particle at time t. [5]

View solution

© UCLES 2017

BLANK PAGE

Permission to reproduce items where third-party owned material protected by copyright is included has been sought and cleared where possible. Every reasonable effort has been made by the publisher (UCLES) to trace copyright holders, but if any items requiring clearance have unwittingly been included, the publisher will be pleased to make amends at the earliest possible opportunity.

To avoid the issue of disclosure of answer-related information to candidates, all copyright acknowledgements are reproduced online in the Cambridge International Examinations Copyright Acknowledgements Booklet. This is produced for each series of examinations and is freely available to download at www.cie.org.uk after the live examination series.

Cambridge International Examinations is part of the Cambridge Assessment Group. Cambridge Assessment is the brand name of University of Cambridge Local Examinations Syndicate (UCLES), which is itself a department of the University of Cambridge.