Cambridge IGCSE

Cambridge International Examinations
Cambridge International General Certificate of Secondary Education

CANDIDATE NAME									
CENTRE NUMBER						CANDIDATE NUMBER				

ADDITIONAL MATHEMATICS **0606/23**

Paper 2 **May/June 2017**

2 hours

Candidates answer on the Question Paper.

Additional Materials: Electronic calculator

READ THESE INSTRUCTIONS FIRST

Write your Centre number, candidate number and name on all the work you hand in.
Write in dark blue or black pen.
You may use an HB pencil for any diagrams or graphs.
Do not use staples, paper clips, glue or correction fluid.
DO **NOT** WRITE IN ANY BARCODES.

Answer **all** the questions.
Give non-exact numerical answers correct to 3 significant figures, or 1 decimal place in the case of angles in degrees, unless a different level of accuracy is specified in the question.
The use of an electronic calculator is expected, where appropriate.
You are reminded of the need for clear presentation in your answers.

At the end of the examination, fasten all your work securely together.
The number of marks is given in brackets [ ] at the end of each question or part question.
The total number of marks for this paper is 80.

This document consists of **15** printed pages and **1** blank page.

© UCLES 2017

CAMBRIDGE International Examinations

Mathematical Formulae

1. ALGEBRA

Quadratic Equation

For the equation $ax^2 + bx + c = 0$,

$$x = \frac{-b \pm \sqrt{b^2 - 4ac}}{2a}$$

Binomial Theorem

$$(a + b)^n = a^n + \binom{n}{1} a^{n-1} b + \binom{n}{2} a^{n-2} b^2 + \ldots + \binom{n}{r} a^{n-r} b^r + \ldots + b^n,$$

where n is a positive integer and $\binom{n}{r} = \frac{n!}{(n-r)!r!}$

2. TRIGONOMETRY

Identities

$$\sin^2 A + \cos^2 A = 1$$

$$\sec^2 A = 1 + \tan^2 A$$

$$\operatorname{cosec}^2 A = 1 + \cot^2 A$$

Formulae for ΔABC

$$\frac{a}{\sin A} = \frac{b}{\sin B} = \frac{c}{\sin C}$$

$$a^2 = b^2 + c^2 - 2bc \cos A$$

$$\Delta = \frac{1}{2} bc \sin A$$

© UCLES 2017

1 **(a)** Solve the equation $7^{2x+5} = 2.5$, giving your answer correct to 2 decimal places. [3]

View solution

(b) Express $\dfrac{(5\sqrt{q})^3}{(625p^{12}q)^{\frac{1}{4}}}$ in the form $5^a p^b q^c$, where a, b and c are constants. [3]

View solution

© UCLES 2017

2

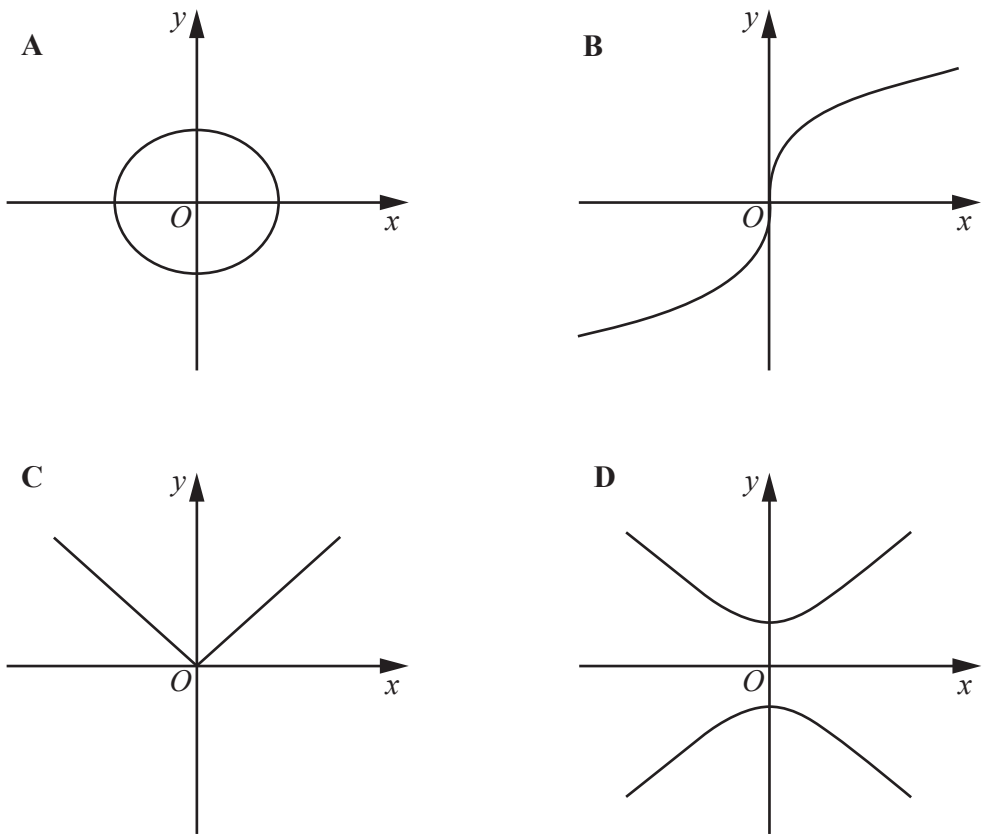

The four graphs above are labelled **A**, **B**, **C** and **D**.

(i) Write down the letter of each graph that represents a function, giving a reason for your choice. [2]

View solution

(ii) Write down the letter of each graph that represents a function which has an inverse, giving a reason for your choice. [2]

View solution

© UCLES 2017

3

View solution

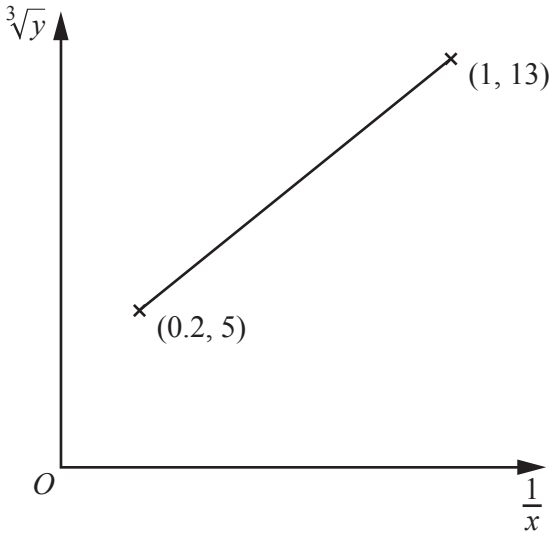

Variables x and y are such that when $\sqrt[3]{y}$ is plotted against $\frac{1}{x}$, a straight line graph passing through the points (0.2, 5) and (1, 13) is obtained. Express y in terms of x. [4]

© UCLES 2017

4 **(a)** Vectors **a**, **b** and **c** are such that $\mathbf{a} = \begin{pmatrix} 5 \\ -6 \end{pmatrix}$, $\mathbf{b} = \begin{pmatrix} 11 \\ -15 \end{pmatrix}$ and $3\mathbf{a} + \mathbf{c} = \mathbf{b}$.

(i) Find **c**. [1]

View solution

(ii) Find the unit vector in the direction of **b**. [2]

View solution

(b)

View solution

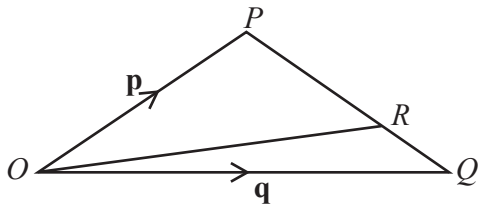

In the diagram, $\overrightarrow{OP} = \mathbf{p}$ and $\overrightarrow{OQ} = \mathbf{q}$. The point R lies on PQ such that $PR = 3RQ$. Find $\overrightarrow{OR}$ in terms of **p** and **q**, simplifying your answer. [3]

5 **(a)** How many 5-digit numbers are there that have 5 different digits and are divisible by 5? [3]

View solution

(b) A committee of 8 people is to be selected from 9 men and 5 women. Find the number of different committees that can be selected if the committee must have at least 4 women. [3]

View solution

© UCLES 2017

6 The first three terms of the binomial expansion of $(2 - ax)^n$ are $64 - 16bx + 100bx^2$. Find the value of each of the integers n, a and b. [7]

View solution

7 Differentiate with respect to x,

(i) $(1+4x)^{10}\cos x$, [4]

View solution

(ii) $\dfrac{e^{4x-5}}{\tan x}$. [4]

View solution

8

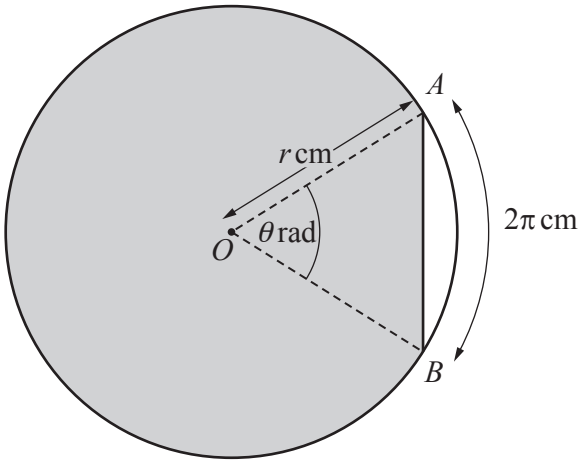

The diagram shows a circle, centre O of radius r cm, and a chord AB. Angle $AOB = \theta$ radians. The length of the major arc AB is 5 times the length of the minor arc AB. The minor arc AB has length 2π cm.

(i) Find the value of θ and of r. [2]

View solution

(ii) Calculate the exact perimeter of the shaded segment. [2]

View solution

(iii) Calculate the exact area of the shaded segment. [4]

View solution

© UCLES 2017

9 The functions f and g are defined, for $x > 1$, by

$$\mathrm{f}(x) = 9\sqrt{x-1},$$
$$\mathrm{g}(x) = x^2 + 2.$$

(i) Find an expression for $\mathrm{f}^{-1}(x)$, stating its domain. [3]

View solution

(ii) Find the exact value of fg(7). [2]

View solution

(iii) Solve $\mathrm{gf}(x) = 5x^2 + 83x - 95$. [4]

View solution

10 Solve the equation

(a) $2|\sin x| = 1$ for $-\pi \leqslant x \leqslant \pi$ radians, [3]

View solution

(b) $3\tan(2y + 15°) = 1$ for $0° \leqslant y \leqslant 180°$, [4]

View solution

(c) $3\cot^2 z = \operatorname{cosec}^2 z - 7\operatorname{cosec} z + 1 \quad \text{for} \quad 0° \leqslant z \leqslant 360°.$ [5]

View solution

11

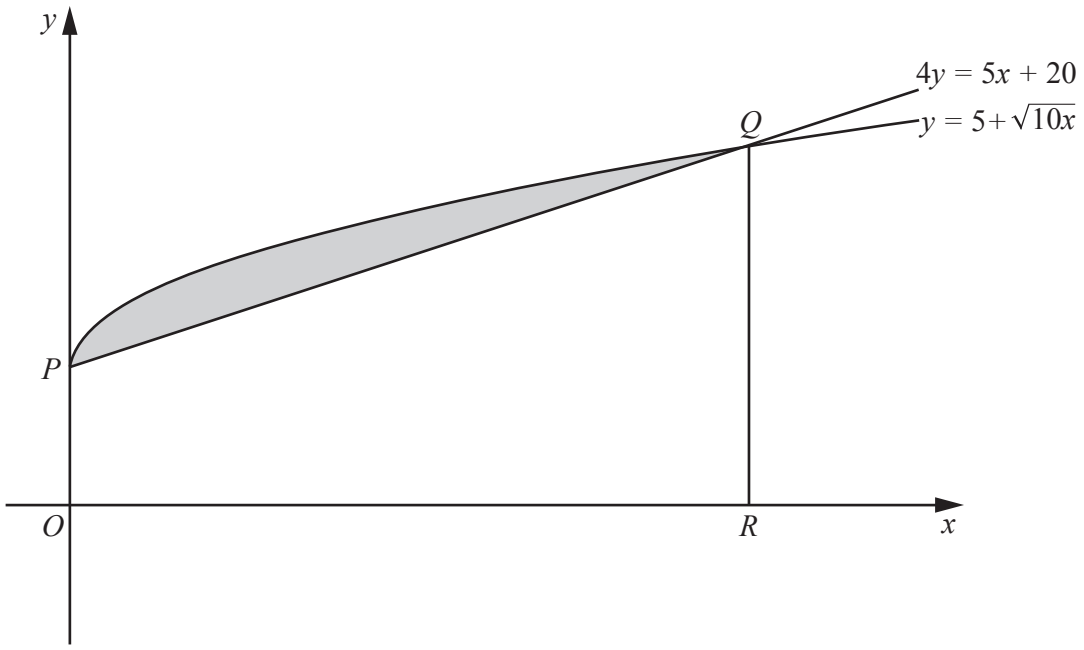

The diagram shows part of the curve $y = 5 + \sqrt{10x}$ and the line $4y = 5x + 20$. The line and curve intersect at the points $P(0, 5)$ and Q. The line QR is parallel to the y-axis.

(i) Find the coordinates of Q. [4]

View solution

(ii) Find the area of the shaded region. You must show all your working. [6]

View solution

BLANK PAGE

Permission to reproduce items where third-party owned material protected by copyright is included has been sought and cleared where possible. Every reasonable effort has been made by the publisher (UCLES) to trace copyright holders, but if any items requiring clearance have unwittingly been included, the publisher will be pleased to make amends at the earliest possible opportunity.

To avoid the issue of disclosure of answer-related information to candidates, all copyright acknowledgements are reproduced online in the Cambridge International Examinations Copyright Acknowledgements Booklet. This is produced for each series of examinations and is freely available to download at www.cie.org.uk after the live examination series.

Cambridge International Examinations is part of the Cambridge Assessment Group. Cambridge Assessment is the brand name of University of Cambridge Local Examinations Syndicate (UCLES), which is itself a department of the University of Cambridge.