Cambridge IGCSE

Cambridge International Examinations
Cambridge International General Certificate of Secondary Education

CANDIDATE NAME	
CENTRE NUMBER	
CANDIDATE NUMBER	

ADDITIONAL MATHEMATICS **0606/12**

Paper 1 **May/June 2018**

2 hours

Candidates answer on the Question Paper.

Additional Materials: Electronic calculator

READ THESE INSTRUCTIONS FIRST

Write your Centre number, candidate number and name on all the work you hand in.
Write in dark blue or black pen.
You may use an HB pencil for any diagrams or graphs.
Do not use staples, paper clips, glue or correction fluid.
DO **NOT** WRITE IN ANY BARCODES.

Answer **all** the questions.
Give non-exact numerical answers correct to 3 significant figures, or 1 decimal place in the case of angles in degrees, unless a different level of accuracy is specified in the question.
The use of an electronic calculator is expected, where appropriate.
You are reminded of the need for clear presentation in your answers.

At the end of the examination, fasten all your work securely together.
The number of marks is given in brackets [ ] at the end of each question or part question.
The total number of marks for this paper is 80.

This document consists of **16** printed pages.

© UCLES 2018

Mathematical Formulae

1. ALGEBRA

Quadratic Equation

For the equation $ax^2 + bx + c = 0$,

$$x = \frac{-b \pm \sqrt{b^2 - 4ac}}{2a}$$

Binomial Theorem

$$(a + b)^n = a^n + \binom{n}{1} a^{n-1} b + \binom{n}{2} a^{n-2} b^2 + \ldots + \binom{n}{r} a^{n-r} b^r + \ldots + b^n,$$

where n is a positive integer and $\binom{n}{r} = \frac{n!}{(n-r)!r!}$

2. TRIGONOMETRY

Identities

$$\sin^2 A + \cos^2 A = 1$$

$$\sec^2 A = 1 + \tan^2 A$$

$$\operatorname{cosec}^2 A = 1 + \cot^2 A$$

Formulae for ΔABC

$$\frac{a}{\sin A} = \frac{b}{\sin B} = \frac{c}{\sin C}$$

$$a^2 = b^2 + c^2 - 2bc \cos A$$

$$\Delta = \frac{1}{2} bc \sin A$$

© UCLES 2018

1 It is given that $y = 1 + \tan 3x$.

(i) State the period of y. [1]

View solution

(ii) On the axes below, sketch the graph of $y = 1 + \tan 3x$ for $0° \leqslant x° \leqslant 180°$. [3]

View solution

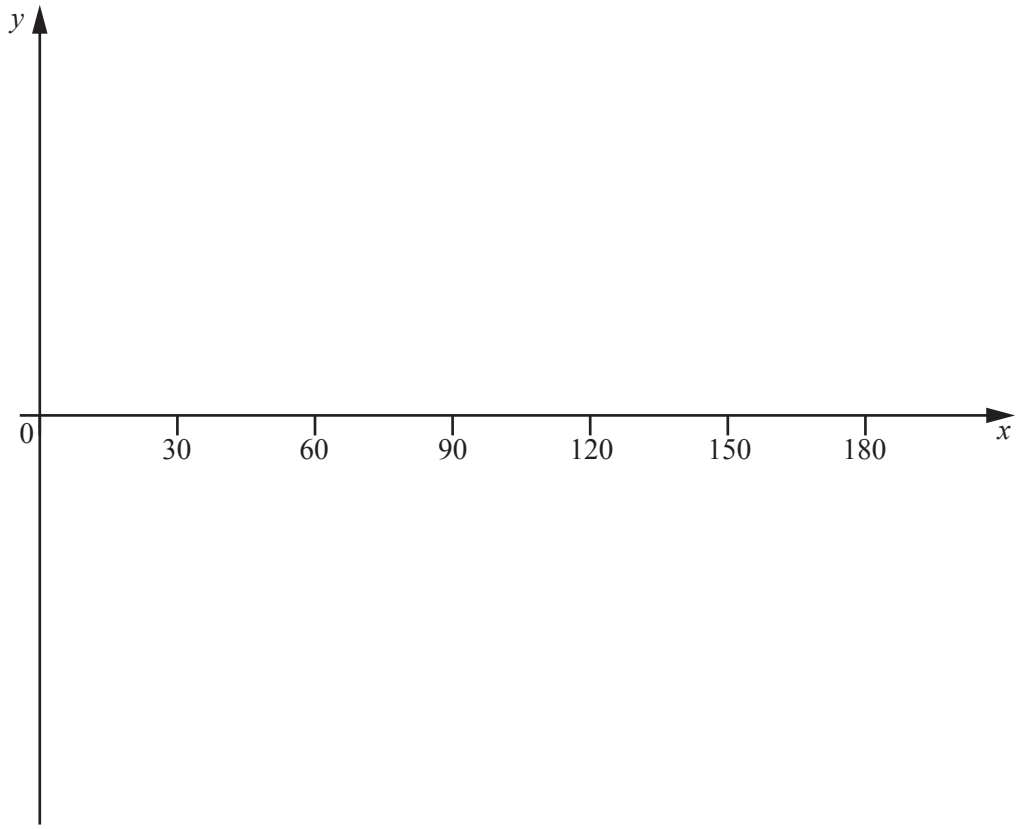

2 Find the values of k for which the line $y = 1 - 2kx$ does not meet the curve $y = 9x^2 - (3k + 1)x + 5$. [5]

View solution

3 The variables x and y are such that when e^y is plotted against x^2, a straight line graph passing through the points (5, 3) and (3, 1) is obtained. Find y in terms of x. [5]

View solution

4 A particle P moves so that its displacement, x metres from a fixed point O, at time t seconds, is given by $x = \ln(5t + 3)$.

(i) Find the value of t when the displacement of P is 3m. [2]

View solution

(ii) Find the velocity of P when $t = 0$. [2]

View solution

(iii) Explain why, after passing through O, the velocity of P is never negative. [1]

View solution

(iv) Find the acceleration of P when $t = 0$. [2]

View solution

© UCLES 2018

5 **(i)** The first three terms in the expansion of $\left(3-\frac{1}{9x}\right)^5$ can be written as $a+\frac{b}{x}+\frac{c}{x^2}$. Find the value of each of the constants a, b and c. [3]


View solution

(ii) Use your values of a, b and c to find the term independent of x in the expansion of

$$\left(3-\frac{1}{9x}\right)^5(2+9x)^2.$$ [3]


View solution

6 Find the coordinates of the stationary point of the curve $y = \dfrac{x+2}{\sqrt{2x-1}}$. [6]

View solution

7 A population, B, of a particular bacterium, t hours after measurements began, is given by $B = 1000e^{\frac{t}{4}}$.

(i) Find the value of B when $t = 0$. [1]

View solution

(ii) Find the time taken for B to double in size. [3]

View solution

(iii) Find the value of B when $t = 8$. [1]

View solution

© UCLES 2018

8 **(a)** Solve $3\cos^2\theta + 4\sin\theta = 4$ for $0° \leqslant \theta \leqslant 180°$. [4]

View solution

(b) Solve $\sin 2\phi = \sqrt{3}\cos 2\phi$ for $-\frac{\pi}{2} \leqslant \phi \leqslant \frac{\pi}{2}$ radians. [4]

View solution

© UCLES 2018

9 **(a)** **(i)** Solve $\lg x = 3$. [1]

View solution

(ii) Write $\lg a - 2\lg b + 3$ as a single logarithm. [3]

View solution

(b) **(i)** Solve $x - 5 + \frac{6}{x} = 0$. [2]

View solution

(ii) Hence, showing all your working, find the values of a such that $\log_4 a - 5 + 6\log_a 4 = 0$. [3]

View solution

© UCLES 2018

10 Do not use a calculator in this question.

All lengths in this question are in centimetres.

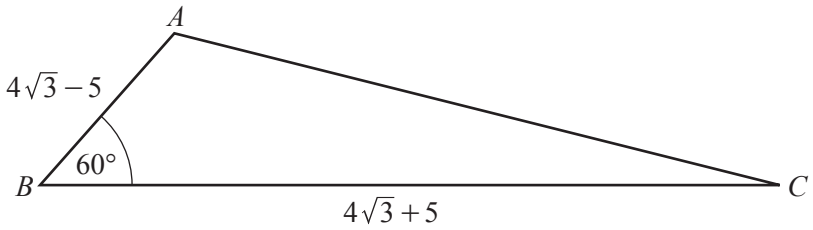

The diagram shows the triangle ABC, where $AB = 4\sqrt{3} - 5$, $BC = 4\sqrt{3} + 5$ and angle $ABC = 60°$.

It is known that $\sin 60° = \frac{\sqrt{3}}{2}$, $\cos 60° = \frac{1}{2}$, $\tan 60° = \sqrt{3}$.

(i) Find the exact value of AC. [4]

View solution

(ii) Hence show that $\operatorname{cosec} ACB = \dfrac{2\sqrt{p}}{q}(4\sqrt{3}+5)$, where p and q are integers. [4]

View solution

11

View solution

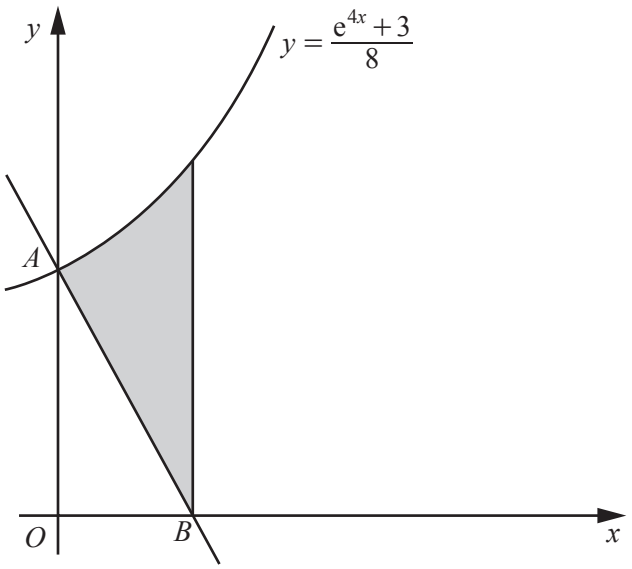

The diagram shows the graph of the curve $y = \frac{e^{4x} + 3}{8}$. The curve meets the y-axis at the point A.

The normal to the curve at A meets the x-axis at the point B. Find the area of the shaded region enclosed by the curve, the line AB and the line through B parallel to the y-axis. Give your answer in the form $\frac{e}{a}$, where a is a constant. You must show all your working.

[10]

© UCLES 2018

Question 12 is printed on the next page.

12 Do not use a calculator in this question.

(a) Given that $\dfrac{6^p \times 8^{p+2} \times 3^q}{9^{2q-3}}$ is equal to $2^7 \times 3^4$, find the value of each of the constants p and q. [3]

View solution

(b) Using the substitution $u = x^{\frac{1}{3}}$, or otherwise, solve $4x^{\frac{1}{3}} + x^{\frac{2}{3}} + 3 = 0$. [4]

View solution

Permission to reproduce items where third-party owned material protected by copyright is included has been sought and cleared where possible. Every reasonable effort has been made by the publisher (UCLES) to trace copyright holders, but if any items requiring clearance have unwittingly been included, the publisher will be pleased to make amends at the earliest possible opportunity.

To avoid the issue of disclosure of answer-related information to candidates, all copyright acknowledgements are reproduced online in the Cambridge International Examinations Copyright Acknowledgements Booklet. This is produced for each series of examinations and is freely available to download at www.cie.org.uk after the live examination series.

Cambridge International Examinations is part of the Cambridge Assessment Group. Cambridge Assessment is the brand name of University of Cambridge Local Examinations Syndicate (UCLES), which is itself a department of the University of Cambridge.

© UCLES 2018