Cambridge IGCSE

Cambridge Assessment International Education
Cambridge International General Certificate of Secondary Education

CANDIDATE NAME									
CENTRE NUMBER						CANDIDATE NUMBER				

ADDITIONAL MATHEMATICS **0606/23**

Paper 2 **May/June 2019**

2 hours

Candidates answer on the Question Paper.

Additional Materials: Electronic calculator

READ THESE INSTRUCTIONS FIRST

Write your centre number, candidate number and name on all the work you hand in.
Write in dark blue or black pen.
You may use an HB pencil for any diagrams or graphs.
Do not use staples, paper clips, glue or correction fluid.
DO **NOT** WRITE IN ANY BARCODES.

Answer **all** the questions.
Give non-exact numerical answers correct to 3 significant figures, or 1 decimal place in the case of angles in degrees, unless a different level of accuracy is specified in the question.
The use of an electronic calculator is expected, where appropriate.
You are reminded of the need for clear presentation in your answers.

At the end of the examination, fasten all your work securely together.
The number of marks is given in brackets [ ] at the end of each question or part question.
The total number of marks for this paper is 80.

This document consists of **16** printed pages.

© UCLES 2019

Cambridge Assessment International Education

Mathematical Formulae

1. ALGEBRA

Quadratic Equation

For the equation $ax^2 + bx + c = 0$,

$$x = \frac{-b \pm \sqrt{b^2 - 4ac}}{2a}$$

Binomial Theorem

$$(a + b)^n = a^n + \binom{n}{1} a^{n-1} b + \binom{n}{2} a^{n-2} b^2 + \ldots + \binom{n}{r} a^{n-r} b^r + \ldots + b^n,$$

where n is a positive integer and $\binom{n}{r} = \frac{n!}{(n-r)!r!}$

2. TRIGONOMETRY

Identities

$$\sin^2 A + \cos^2 A = 1$$

$$\sec^2 A = 1 + \tan^2 A$$

$$\operatorname{cosec}^2 A = 1 + \cot^2 A$$

Formulae for ΔABC

$$\frac{a}{\sin A} = \frac{b}{\sin B} = \frac{c}{\sin C}$$

$$a^2 = b^2 + c^2 - 2bc \cos A$$

$$\Delta = \frac{1}{2} bc \sin A$$

© UCLES 2019

1 Find the values of x for which $9x^2 + 18x - 1 < x + 1$. [3]

View solution

2 Differentiate $\tan 3x \cos\frac{x}{2}$ with respect to x. [4]

View solution

© UCLES 2019

3 The points A, B and C have coordinates (4, 7), (−3, 9) and (6, 4) respectively.

(i) Find the equation of the line, L, that is parallel to the line AB and passes through C. Give your answer in the form $ax + by = c$, where a, b and c are integers. [3]

View solution

(ii) The line L meets the x-axis at the point D and the y-axis at the point E. Find the length of DE. [2]

View solution

© UCLES 2019

4 The function f is defined, for $0° \leqslant x \leqslant 360°$, by $\mathrm{f}(x) = 4 + 3\sin 2x$.

(i) Sketch the graph of $y = \mathrm{f}(x)$ on the axes below.

View solution

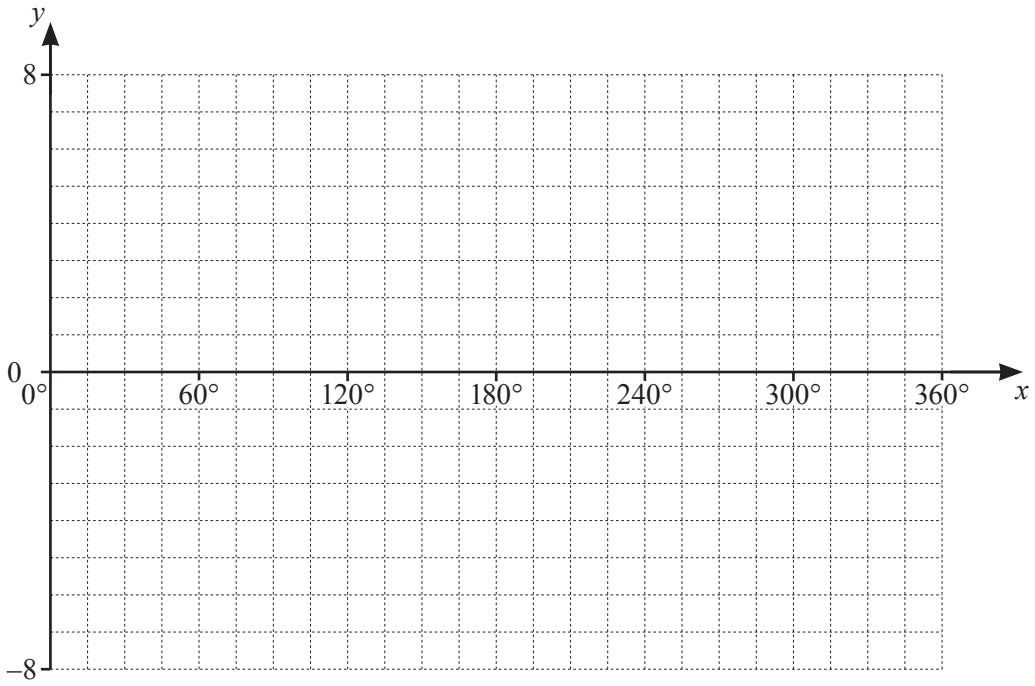

[3]

(ii) State the period of f. [1]

View solution

(iii) State the amplitude of f. [1]

View solution

© UCLES 2019

5 **(a)** Given that $\mathbf{A} = \begin{pmatrix} 2 & 3 \\ 0 & -1 \\ 6 & 4 \end{pmatrix}$ and that $\mathbf{A} + \mathbf{O} = \mathbf{A}$,

View solution

(i) state the order of the matrix **A**, [1]

(ii) write down the matrix **O**. [1]

View solution

(b) $\mathbf{B} = \begin{pmatrix} 1 & -1 \\ 3 & 2 \end{pmatrix}$ and $\mathbf{C} = \begin{pmatrix} 0.4 & 0.2 \\ -0.6 & 0.2 \end{pmatrix}$.

View solution

Find the matrix product **BC** and state a relationship between **B** and **C**. [2]

(c) $\mathbf{D} = \begin{pmatrix} a & 4a \\ -1 & 5 \end{pmatrix}$, where a is a positive integer. Find $\mathbf{D}^{-1}$ in terms of a. [2]

View solution

© UCLES 2019

6 A curve has equation $y = (3x - 5)^3 - 2x$.

(i) Find $\frac{dy}{dx}$ and $\frac{d^2y}{dx^2}$. [4]

View solution

(ii) Find the exact value of the x-coordinate of each of the stationary points of the curve. [2]

View solution

(iii) Use the second derivative test to determine the nature of each of the stationary points. [2]

View solution

© UCLES 2019

7

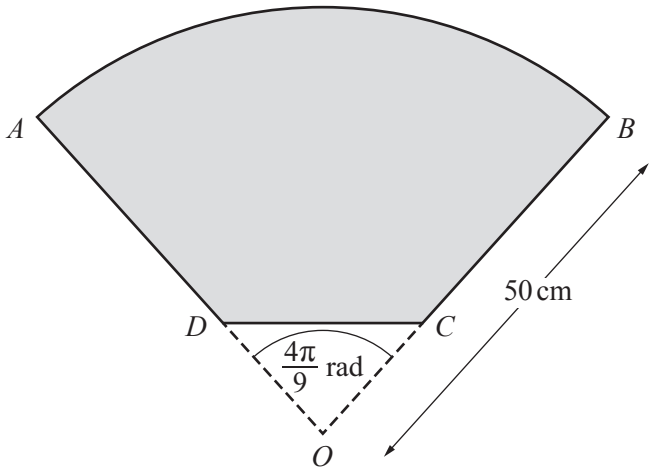

The diagram shows a company logo, *ABCD*. The logo is part of a sector, *AOB*, of a circle, centre *O* and radius 50 cm. The points *C* and *D* lie on *OB* and *OA* respectively. The lengths *AD* and *BC* are equal and $AD : AO$ is 7 : 10. The angle *AOB* is $\frac{4\pi}{9}$ radians.

(i) Find the perimeter of *ABCD*. [5]

View solution

(ii) Find the area of $ABCD$. [3]

View solution

8 **(a)** **(i)** Given that $\left(x^2 - \frac{1}{px}\right)^8 = x^{16} - 4x^{13} + qx^{10} + rx^7 + \ldots$, find the value of each of the constants p, q and r. [3]

View solution

(ii) Explain why there is no term independent of x in the binomial expansion of $\left(x^2 - \frac{1}{px}\right)^8$. [1]

View solution

(b) In the binomial expansion of $\left(1 - \frac{\sqrt{x}}{2}\right)^n$, where n is a positive integer, the coefficient of x is 30. Form an equation in n and hence find the value of n. [4]

View solution

© UCLES 2019

9

View solution

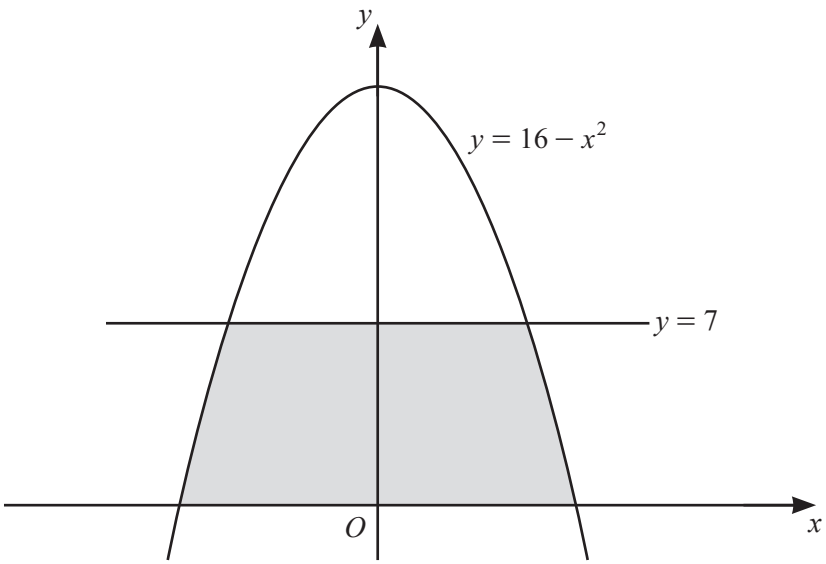

The diagram shows the curve $y = 16 - x^2$ and the straight line $y = 7$. Find the area of the shaded region. You must show all your working. [6]

© UCLES 2019

10

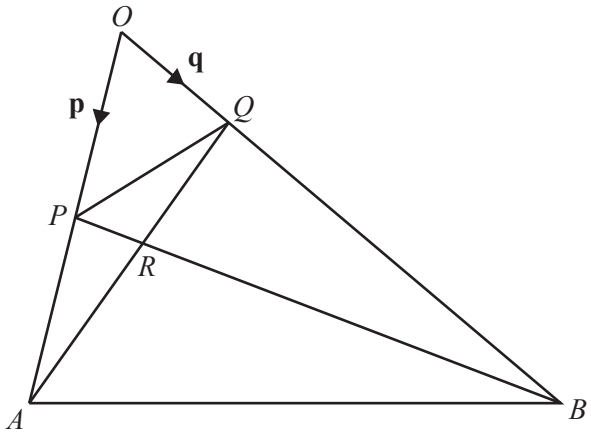

The diagram shows a triangle OAB. The point P is the midpoint of OA and the point Q lies on OB such that $\overrightarrow{OQ} = \frac{1}{4}\overrightarrow{OB}$. The position vectors of P and Q relative to O are **p** and **q** respectively.

(i) Find, in terms of **p** and **q**, an expression for each of the vectors $\overrightarrow{PQ}$, $\overrightarrow{QA}$ and $\overrightarrow{PB}$. [3]

View solution

(ii) Given that $\overrightarrow{PR} = \lambda\overrightarrow{PB}$ and that $\overrightarrow{QR} = \mu\overrightarrow{QA}$, find an expression for $\overrightarrow{PQ}$ in terms of λ, μ, **p** and **q**. [2]

View solution

© UCLES 2019

(iii) Using your expressions for $\overrightarrow{PQ}$, find the value of λ and of μ. [4]

View solution

11 A particle travelling in a straight line passes through a fixed point O. The displacement, x metres, of the particle, t seconds after it passes through O, is given by $x = 5t + \sin t$.

(i) Show that the particle is never at rest. [2]

View solution

(ii) Find the distance travelled by the particle between $t = \frac{\pi}{3}$ and $t = \frac{\pi}{2}$. [2]

View solution

(iii) Find the acceleration of the particle when $t = 4$. [2]

View solution

(iv) Find the value of t when the velocity of the particle is first at its minimum. [2]

View solution

Question 12 is printed on the next page.

© UCLES 2019

12 Do not use a calculator in this question.

The line $y = 4x - 6$ intersects the curve $y = 10x^3 - 19x^2 - x$ at the points A, B, and C. Given that C is the point (2, 2), find the coordinates of the midpoint of AB. [10]

View solution

Permission to reproduce items where third-party owned material protected by copyright is included has been sought and cleared where possible. Every reasonable effort has been made by the publisher (UCLES) to trace copyright holders, but if any items requiring clearance have unwittingly been included, the publisher will be pleased to make amends at the earliest possible opportunity.

To avoid the issue of disclosure of answer-related information to candidates, all copyright acknowledgements are reproduced online in the Cambridge Assessment International Education Copyright Acknowledgements Booklet. This is produced for each series of examinations and is freely available to download at www.cambridgeinternational.org after the live examination series.

Cambridge Assessment International Education is part of the Cambridge Assessment Group. Cambridge Assessment is the brand name of the University of Cambridge Local Examinations Syndicate (UCLES), which itself is a department of the University of Cambridge.

© UCLES 2019