Cambridge Assessment International Education

Cambridge IGCSE™

CANDIDATE NAME									
CENTRE NUMBER						CANDIDATE NUMBER				

ADDITIONAL MATHEMATICS **0606/21**

Paper 2 **May/June 2023**

2 hours

You must answer on the question paper.

No additional materials are needed.

INSTRUCTIONS

- Answer **all** questions.
- Use a black or dark blue pen. You may use an HB pencil for any diagrams or graphs.
- Write your name, centre number and candidate number in the boxes at the top of the page.
- Write your answer to each question in the space provided.
- Do **not** use an erasable pen or correction fluid.
- Do **not** write on any bar codes.
- You should use a calculator where appropriate.
- You must show all necessary working clearly; no marks will be given for unsupported answers from a calculator.
- Give non-exact numerical answers correct to 3 significant figures, or 1 decimal place for angles in degrees, unless a different level of accuracy is specified in the question.

INFORMATION

- The total mark for this paper is 80.
- The number of marks for each question or part question is shown in brackets [ ].

© UCLES 2023

Mathematical Formulae

1. ALGEBRA

Quadratic Equation

For the equation $ax^2 + bx + c = 0$,

$$x = \frac{-b \pm \sqrt{b^2 - 4ac}}{2a}$$

Binomial Theorem

$$(a+b)^n = a^n + \binom{n}{1}a^{n-1}b + \binom{n}{2}a^{n-2}b^2 + \ldots + \binom{n}{r}a^{n-r}b^r + \ldots + b^n$$

where n is a positive integer and $\binom{n}{r} = \frac{n!}{(n-r)!r!}$

Arithmetic series $u_n = a + (n-1)d$

$$S_n = \frac{1}{2}n(a+l) = \frac{1}{2}n\{2a + (n-1)d\}$$

Geometric series $u_n = ar^{n-1}$

$$S_n = \frac{a(1-r^n)}{1-r} \quad (r \neq 1)$$

$$S_\infty = \frac{a}{1-r} \quad (|r| < 1)$$

2. TRIGONOMETRY

Identities

$$\sin^2 A + \cos^2 A = 1$$
$$\sec^2 A = 1 + \tan^2 A$$
$$\operatorname{cosec}^2 A = 1 + \cot^2 A$$

Formulae for ΔABC

$$\frac{a}{\sin A} = \frac{b}{\sin B} = \frac{c}{\sin C}$$

$$a^2 = b^2 + c^2 - 2bc\cos A$$

$$\Delta = \frac{1}{2}bc\sin A$$

© UCLES 2023

1 Variables x and y are such that when $\lg y$ is plotted against $\sqrt{x}$ a straight line passing through the points (1, 5) and (2.5, 8) is obtained. Show that $y = A \times b^{\sqrt{x}}$ where A and b are constants to be found. [4]

View solution

2 The function g is defined for $0° \leqslant x \leqslant 120°$ by $g(x) = 2 + 4\cos 6x$.

(a) On the axes, sketch the graph of $y = g(x)$. [3]

View solution

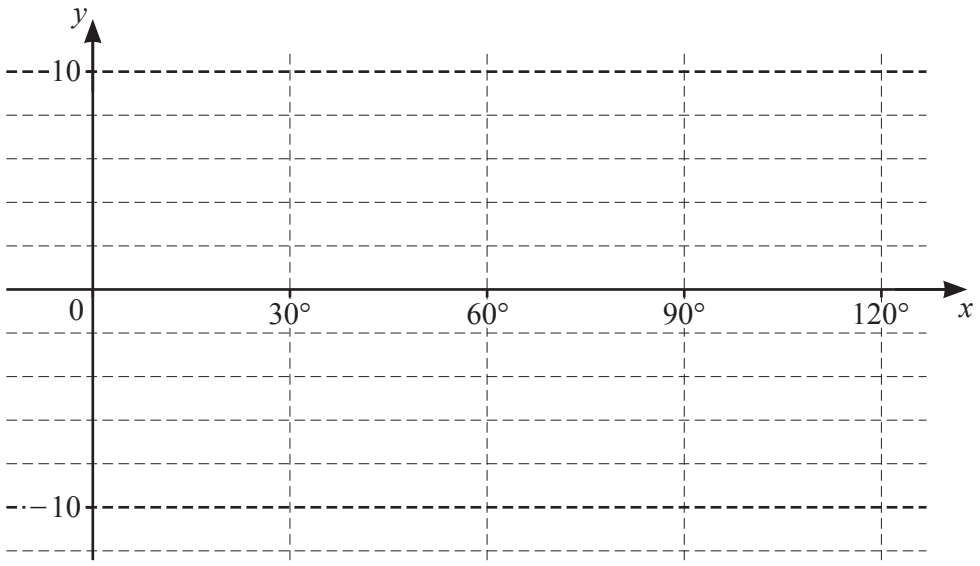

(b) State the amplitude of g. [1]

View solution

(c) State the period of g. [1]

View solution

3

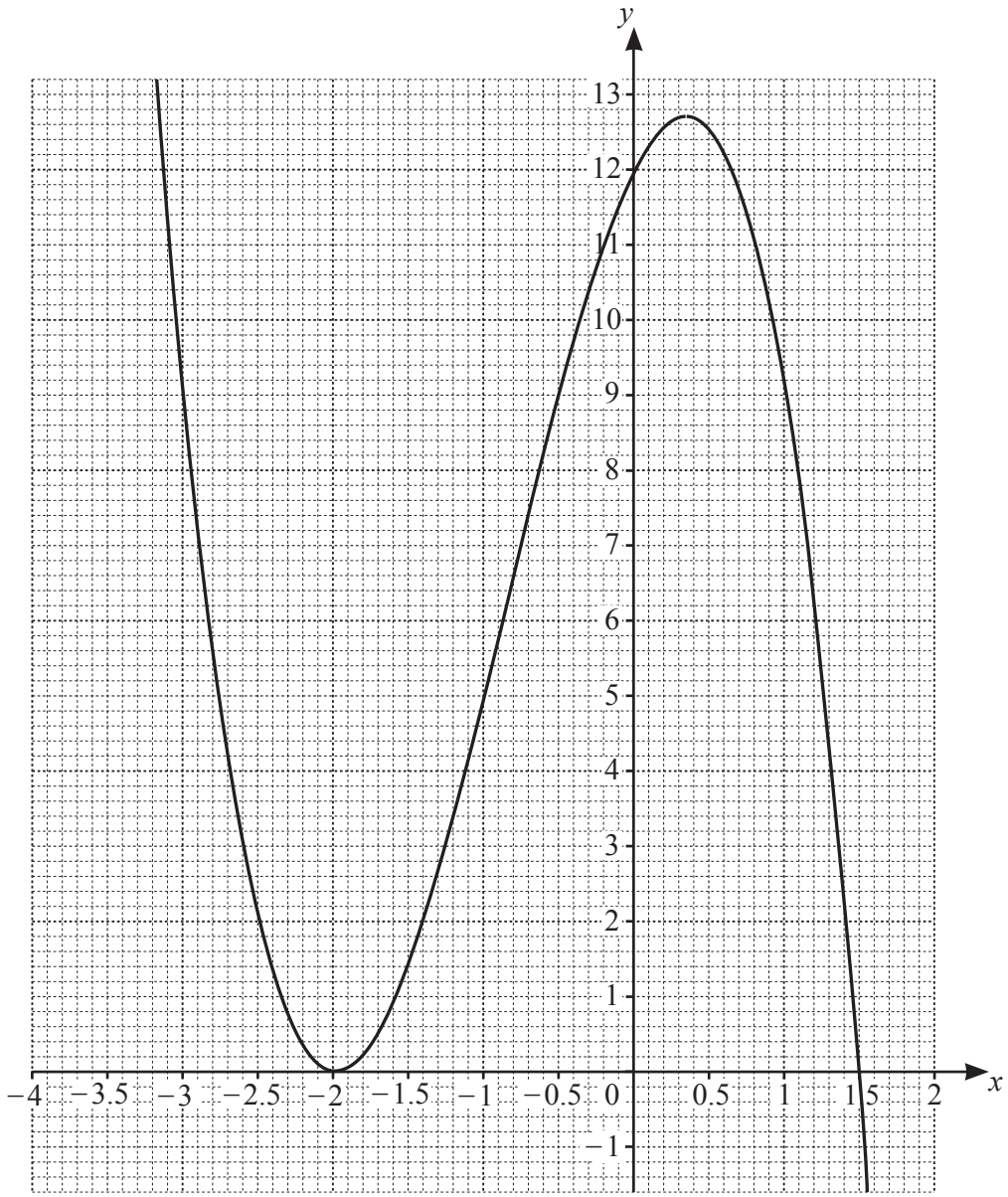

The diagram shows the graph of $y = \mathrm{h}(x)$ where $\mathrm{h}(x) = (x+a)^2(b+cx)$ and a, b and c are integers. The curve meets the x-axis at the points $(-2, 0)$ and $(1.5, 0)$ and the y-axis at the point $(0, 12)$.

(a) Find the values of a, b and c. [2]

View solution

(b) Use the graph to solve the inequality $\mathrm{h}(x) \leqslant 9$. [3]

View solution

© UCLES 2023

4 **(a)** Solve the equation $5^{2y-1} = 6 \times 3^{y}$, giving your answer correct to 3 decimal places. [3]

View solution

(b) Solve the equation $e^{2x} - 4 + 3e^{-2x} = 0$, giving your answers in exact form. [4]

View solution

© UCLES 2023

5 The volume, V, of a sphere of radius r is given by $V = \frac{4}{3}\pi r^3$.

The volume of a sphere is increasing at a constant rate of $24\,\text{cm}^3\,\text{s}^{-1}$. Find the rate of increase of the radius when the radius is 6 cm. [4]

View solution

6 **(a)** The position vectors of the points P, Q and R relative to an origin O are $\begin{pmatrix}4\\7\end{pmatrix}$, $\begin{pmatrix}8\\5\end{pmatrix}$ and $\begin{pmatrix}x\\y\end{pmatrix}$ respectively. The point R lies on PQ extended such that $3\overrightarrow{QR} = 2\overrightarrow{PR}$. Use a vector method to find the values of x and y. [3]

View solution

(b) You are given that **i** is a unit vector due east and **j** is a unit vector due north.

View solution

Three vectors, **a**, **b** and **c** are in the same horizontal plane as **i** and **j** and are such that $\mathbf{a} + \mathbf{b} = \mathbf{c}$.
The magnitude and bearing of **a** are 5 and 210°.
The magnitude and bearing of **c** are 10 and 330°.

(i) Find **a** and **c** in terms of **i** and **j**. [2]

© UCLES 2023

(ii) Find the magnitude and bearing of **b**. [5]

View solution

© UCLES 2023

7 (a)

View solution

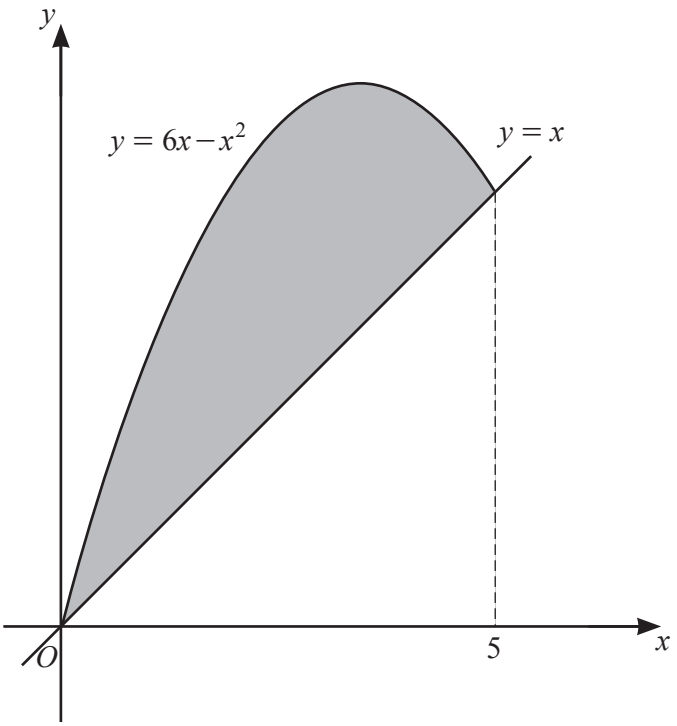

The diagram shows the curve $y = 6x - x^2$ for $0 \leqslant x \leqslant 5$ and the line $y = x$. Find the area of the shaded region. [4]

(b) **(i)** Find $\int\left(\frac{1}{(2x-6)^3}+\cos x\right)\mathrm{d}x$. [3]

View solution

(ii) Find $\int\frac{(x^4+1)^2}{2x}\mathrm{d}x$. [3]

View solution

8 (a)

View solution

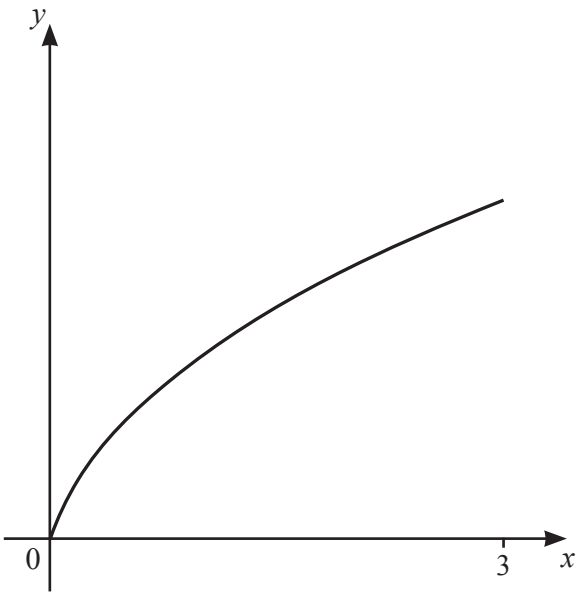

The diagram shows the graph of $y = \mathrm{f}(x)$ where f is defined by $\mathrm{f}(x) = \dfrac{3x}{\sqrt{5x+1}}$ for $0 \leqslant x \leqslant 3$.

(i) Given that f is a one-one function, find the domain and range of f^{-1}. [3]

(ii) Solve the equation $\mathrm{f}(x) = x$. [2]

View solution

(iii) On the diagram above, sketch the graph of $y = \mathrm{f}^{-1}(x)$. [2]

View solution

(b) The functions g and h are defined by

View solution

$$g(x) = \sqrt[3]{8x^3 + 3} \quad \text{for} \quad x \geqslant 1,$$

$$h(x) = e^{4x} \quad \text{for} \quad x \geqslant k.$$

(i) Find an expression for $g^{-1}(x)$. [2]

(ii) State the least value of the constant k such that $gh(x)$ can be formed. [1]

View solution

(iii) Find and simplify an expression for $gh(x)$. [1]

View solution

© UCLES 2023

9 In this question all lengths are in centimetres and all angles are in radians.

(a) The area of a sector of a circle of radius 24 is $432\,\text{cm}^2$. Find the length of the arc of the sector. [4]

View solution

(b)

View solution

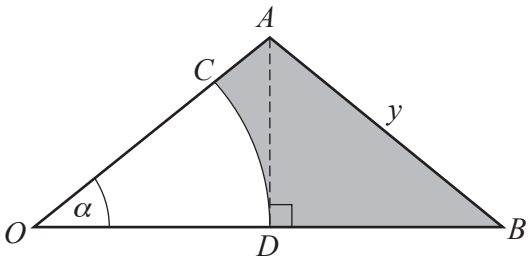

The diagram shows an isosceles triangle, OAB, with $AO = AB = y$ and height AD.
OCD is a sector of the circle with centre O. Angle AOB is α.

(i) Find an expression for OB in terms of y and α. [1]

(ii) Hence show that the area of the shaded region can be written as $\frac{y^2}{2}\cos\alpha(2\sin\alpha - \alpha\cos\alpha)$. [3]

View solution

10 In the expansion of $\left(ax+\frac{b}{x^2}\right)^9$, where a and b are constants with $a > 0$, the term independent of x is $-145\,152$ and the coefficient of x^6 is -6912. Show that $a^2b = -12$ and find the value of a and the value of b. [7]

View solution

Question 11 is printed on the next page.

11 The line with equation $x+3y=k$, where k is a positive constant, is a tangent to the curve with equation $x^2+y^2+2y-9=0$. Find the value of k and hence find the coordinates of the point where the line touches the curve. [9]

View solution

Permission to reproduce items where third-party owned material protected by copyright is included has been sought and cleared where possible. Every reasonable effort has been made by the publisher (UCLES) to trace copyright holders, but if any items requiring clearance have unwittingly been included, the publisher will be pleased to make amends at the earliest possible opportunity.

To avoid the issue of disclosure of answer-related information to candidates, all copyright acknowledgements are reproduced online in the Cambridge Assessment International Education Copyright Acknowledgements Booklet. This is produced for each series of examinations and is freely available to download at www.cambridgeinternational.org after the live examination series.

Cambridge Assessment International Education is part of Cambridge Assessment. Cambridge Assessment is the brand name of the University of Cambridge Local Examinations Syndicate (UCLES), which is a department of the University of Cambridge.

© UCLES 2023