Cambridge Assessment International Education

Cambridge IGCSE™

CANDIDATE NAME									
CENTRE NUMBER						CANDIDATE NUMBER				

ADDITIONAL MATHEMATICS **0606/23**

Paper 2 **May/June 2023**

2 hours

You must answer on the question paper.

No additional materials are needed.

INSTRUCTIONS

- Answer **all** questions.
- Use a black or dark blue pen. You may use an HB pencil for any diagrams or graphs.
- Write your name, centre number and candidate number in the boxes at the top of the page.
- Write your answer to each question in the space provided.
- Do **not** use an erasable pen or correction fluid.
- Do **not** write on any bar codes.
- You should use a calculator where appropriate.
- You must show all necessary working clearly; no marks will be given for unsupported answers from a calculator.
- Give non-exact numerical answers correct to 3 significant figures, or 1 decimal place for angles in degrees, unless a different level of accuracy is specified in the question.

INFORMATION

- The total mark for this paper is 80.
- The number of marks for each question or part question is shown in brackets [ ].

This document has **16** pages. Any blank pages are indicated.

© UCLES 2023

Mathematical Formulae

1. ALGEBRA

Quadratic Equation

For the equation $ax^2 + bx + c = 0$,

$$x = \frac{-b \pm \sqrt{b^2 - 4ac}}{2a}$$

Binomial Theorem

$$(a+b)^n = a^n + \binom{n}{1}a^{n-1}b + \binom{n}{2}a^{n-2}b^2 + \ldots + \binom{n}{r}a^{n-r}b^r + \ldots + b^n$$

where n is a positive integer and $\binom{n}{r} = \frac{n!}{(n-r)!r!}$

Arithmetic series $u_n = a + (n-1)d$

$$S_n = \frac{1}{2}n(a+l) = \frac{1}{2}n\{2a + (n-1)d\}$$

Geometric series $u_n = ar^{n-1}$

$$S_n = \frac{a(1-r^n)}{1-r} \quad (r \neq 1)$$

$$S_\infty = \frac{a}{1-r} \quad (|r| < 1)$$

2. TRIGONOMETRY

Identities

$$\sin^2 A + \cos^2 A = 1$$
$$\sec^2 A = 1 + \tan^2 A$$
$$\operatorname{cosec}^2 A = 1 + \cot^2 A$$

Formulae for ΔABC

$$\frac{a}{\sin A} = \frac{b}{\sin B} = \frac{c}{\sin C}$$

$$a^2 = b^2 + c^2 - 2bc\cos A$$

$$\Delta = \frac{1}{2}bc\sin A$$

© UCLES 2023

1 **(a)** Solve the equation $\frac{|4x-5|}{7} = 1$. [2]

View solution

(b)

View solution

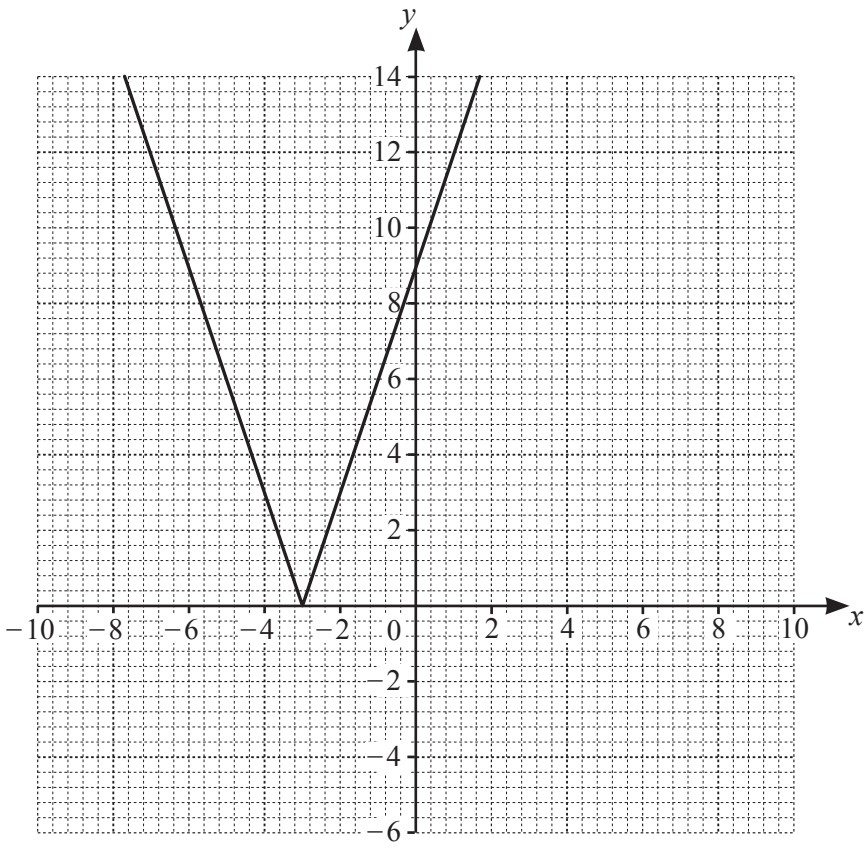

The diagram shows the graph of $y = |3x+9|$.

By drawing a suitable graph on the same diagram, solve the inequality $|3x+9| \leqslant |x-5|$. [3]

© UCLES 2023

2 **DO NOT USE A CALCULATOR IN THIS QUESTION.**

Write the expression $\dfrac{\sqrt{98x^{12}}}{3+\sqrt{2}}$ in the form $\left(a\sqrt{b}+c\right)x^{d}$ where a, b, c and d are integers. [4]

View solution

3 **(a)** Differentiate $\ln(x^3+3x^2)$ with respect to x, simplifying your answer. [2]

View solution

(b) Hence find $\displaystyle\int \frac{x+2}{x(x+3)}\mathrm{d}x$. [2]

View solution

4 The polynomial p is such that $\mathrm{p}(x) = 2x^3 + 11x^2 + 22x + 40$.

(a) Show that $x = -4$ is a root of the equation $\mathrm{p}(x) = 0$. [1]

View solution

(b) Factorise $\mathrm{p}(x)$ and hence show that $\mathrm{p}(x) = 0$ has no other real roots. [4]

View solution

© UCLES 2023

5 **(a)** **(i)** A gardening group has 20 members. A committee of 6 members is to be selected. Anwar and Bo belong to the gardening group and at most one of them can be on the committee. How many different committees are possible? [2]

View solution

(ii) The gate for the garden has a lock with a 6-character passcode. The passcode is to be made from

View solution

Letters	G	A	R	D	E	N				
Numbers	0	1	2	3	4	5	6	7	8	9.

No character may be used more than once in any passcode.
Find the number of possible passcodes that have 4 letters followed by 2 numbers. [2]

© UCLES 2023

(b) (i) Given that $n \geqslant 4$, show that $(n-3) \times {}^{n}C_{3} = 4 \times {}^{n}C_{4}$. [2]

View solution

(ii) Given that ${}^{n}C_{3} = 5n$, where $n \geqslant 3$, show that n satisfies the equation $n^{2} - 3n - 28 = 0$. Hence find the value of n. [4]

View solution

© UCLES 2023

6

View solution

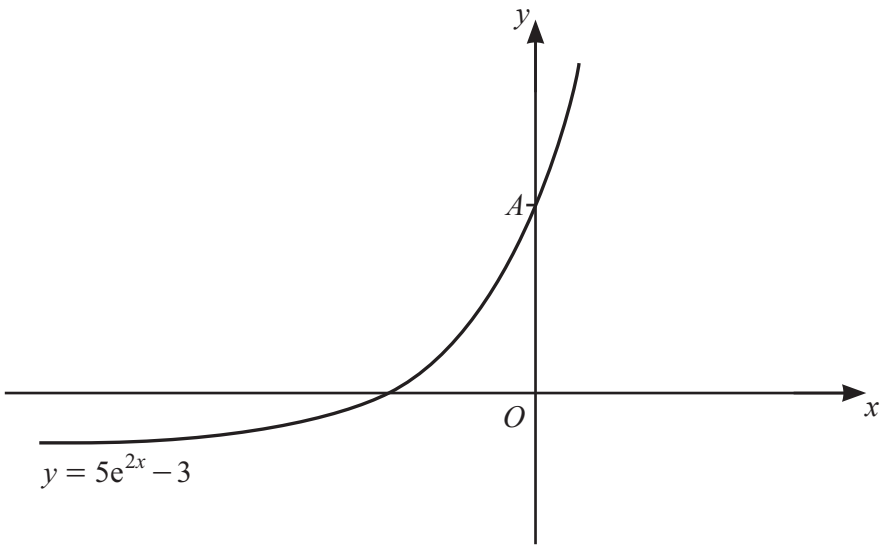

The diagram shows the curve $y = 5e^{2x} - 3$. The curve meets the y-axis at the point A. The tangent to the curve at A meets the x-axis at the point B. Find the length of AB. [6]

7 Variables x and y are such that $y = \dfrac{4x^3 + 2\sin 8x}{1 - x}$. Use differentiation to find the approximate change in y as x increases from 0.1 to $0.1 + h$, where h is small. [6]

View solution

8 **(a)** The functions f and g are defined by

View solution

$$\mathrm{f}(x) = \sec x \qquad \text{for } \frac{\pi}{2} < x < \frac{3\pi}{2}$$

$$\mathrm{g}(x) = 3(x^2 - 1) \qquad \text{for all real } x.$$

(i) Find the range of f. [1]

(ii) Solve the equation $\mathrm{f}^{-1}(x) = \frac{2\pi}{3}$. [3]

View solution

(iii) Given that gf exists, state the domain of gf. [1]

View solution

(iv) Solve the equation $\mathrm{gf}(x) = 1$. [5]

View solution

(b) The function h is defined by $\mathrm{h}(x) = \ln(4-x)$ for $x < 4$. Sketch the graph of $y = \mathrm{h}(x)$ and hence sketch the graph of $y = \mathrm{h}^{-1}(x)$. Show the position of any asymptotes and any points of intersection with the coordinate axes. [4]

View solution

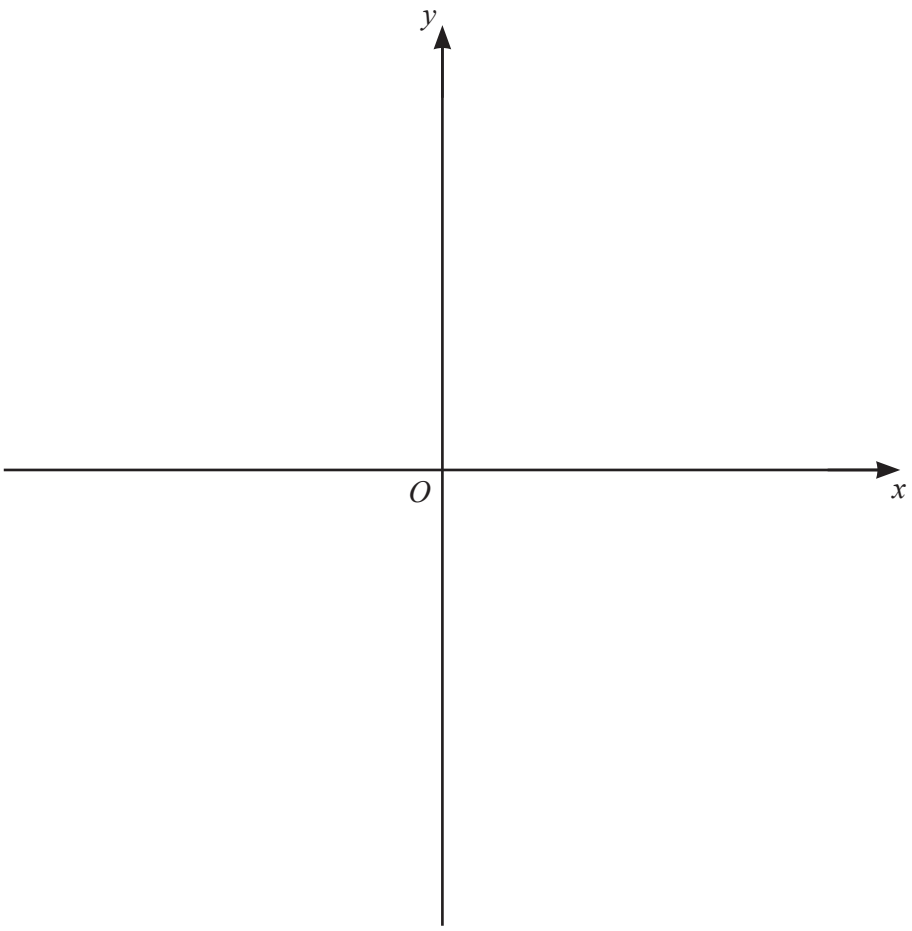

9 **(a)** Show that $\int_1^8 \frac{x+4}{\sqrt[3]{x}}\mathrm{d}x = 36.6$. [3]

View solution

(b)

View solution

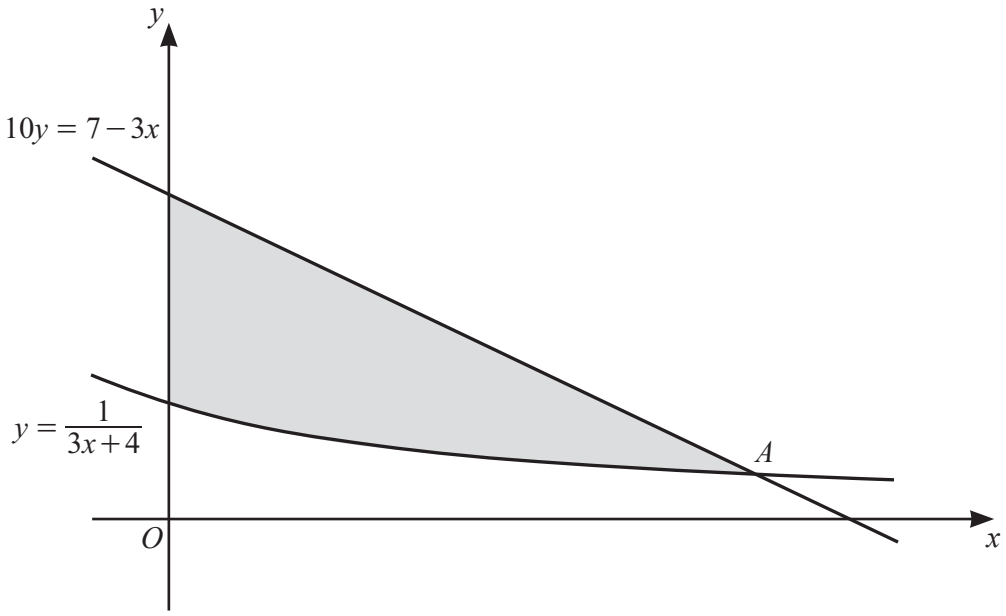

The diagram shows part of the line $10y = 7 - 3x$ and part of the curve $y = \frac{1}{3x+4}$.

The line and curve intersect at the point A. Verify that the y-coordinate of A is 0.1 and calculate the area of the shaded region. [8]

Continuation of working space for Question 9(b).

10 An arithmetic progression, A, has first term a and common difference d.
The 2nd, 14th and 17th terms of A form the first three terms of a convergent geometric progression, G, with common ratio r.

(a) (i) Given that $d \neq 0$, find two expressions for r in terms of a and d and hence show that $a = -17d$. [6]

View solution

(ii) Find the value of r. [2]

View solution

(b) The first term of the geometric progression, G, is q and the sum to infinity is $\frac{256}{3}$.

Find the sum of the first 20 terms of the **arithmetic** progression, A. [7]

View solution

BLANK PAGE

Permission to reproduce items where third-party owned material protected by copyright is included has been sought and cleared where possible. Every reasonable effort has been made by the publisher (UCLES) to trace copyright holders, but if any items requiring clearance have unwittingly been included, the publisher will be pleased to make amends at the earliest possible opportunity.

To avoid the issue of disclosure of answer-related information to candidates, all copyright acknowledgements are reproduced online in the Cambridge Assessment International Education Copyright Acknowledgements Booklet. This is produced for each series of examinations and is freely available to download at www.cambridgeinternational.org after the live examination series.

Cambridge Assessment International Education is part of Cambridge Assessment. Cambridge Assessment is the brand name of the University of Cambridge Local Examinations Syndicate (UCLES), which is a department of the University of Cambridge.

© UCLES 2023