Cambridge Assessment International Education

Cambridge IGCSE™

CANDIDATE NAME									
CENTRE NUMBER						CANDIDATE NUMBER				

ADDITIONAL MATHEMATICS **0606/21**

Paper 2 **May/June 2024**

2 hours

You must answer on the question paper.

No additional materials are needed.

INSTRUCTIONS

- Answer **all** questions.
- Use a black or dark blue pen. You may use an HB pencil for any diagrams or graphs.
- Write your name, centre number and candidate number in the boxes at the top of the page.
- Write your answer to each question in the space provided.
- Do **not** use an erasable pen or correction fluid.
- Do **not** write on any bar codes.
- You should use a calculator where appropriate.
- You must show all necessary working clearly; no marks will be given for unsupported answers from a calculator.
- Give non-exact numerical answers correct to 3 significant figures, or 1 decimal place for angles in degrees, unless a different level of accuracy is specified in the question.

INFORMATION

- The total mark for this paper is 80.
- The number of marks for each question or part question is shown in brackets [ ].

This document has **16** pages. Any blank pages are indicated.

© UCLES 2024

Mathematical Formulae

1. ALGEBRA

Quadratic Equation

For the equation $ax^2 + bx + c = 0$,

$$x = \frac{-b \pm \sqrt{b^2 - 4ac}}{2a}$$

Binomial Theorem

$$(a+b)^n = a^n + \binom{n}{1}a^{n-1}b + \binom{n}{2}a^{n-2}b^2 + \ldots + \binom{n}{r}a^{n-r}b^r + \ldots + b^n$$

where n is a positive integer and $\binom{n}{r} = \frac{n!}{(n-r)!r!}$

Arithmetic series $u_n = a + (n-1)d$

$$S_n = \frac{1}{2}n(a+l) = \frac{1}{2}n\{2a + (n-1)d\}$$

Geometric series $u_n = ar^{n-1}$

$$S_n = \frac{a(1-r^n)}{1-r} \quad (r \neq 1)$$

$$S_\infty = \frac{a}{1-r} \quad (|r| < 1)$$

2. TRIGONOMETRY

Identities

$$\sin^2 A + \cos^2 A = 1$$
$$\sec^2 A = 1 + \tan^2 A$$
$$\operatorname{cosec}^2 A = 1 + \cot^2 A$$

Formulae for ΔABC

$$\frac{a}{\sin A} = \frac{b}{\sin B} = \frac{c}{\sin C}$$

$$a^2 = b^2 + c^2 - 2bc\cos A$$

$$\Delta = \frac{1}{2}bc\sin A$$

© UCLES 2024

1 **(a)** On the axes, sketch the graph of $y = |4x - 6|$, showing the points where the graph meets the axes. [2]

View solution

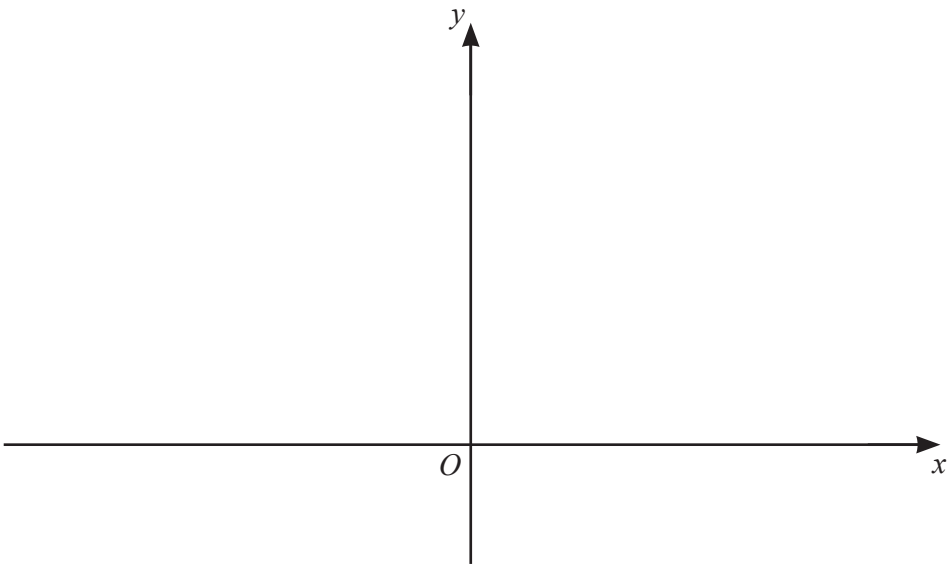

(b) Solve the equation $|4x - 6| = |2x|$. [3]

View solution

2 **(a)** Write $3+4x-2x^2$ in the form $a+b(x+c)^2$, where a, b and c are integers. [3]

View solution

(b) Hence write down the range of the function $\mathrm{f}(x) = 3+4x-2x^2$, where $x \in \mathbb{R}$. [1]

View solution

3 Use algebra to show that the equation $5x(x-3) = 5x-26$ has no real solutions. [3]

View solution

4 DO NOT USE A CALCULATOR IN THIS QUESTION.

(a) Find the exact distance between the two points where the curve $9(x-1)^2+4(y-3)^2=36$ cuts the y-axis. [4]

View solution

(b) Find the coordinates of the points where the curve with equation $2x^2+83xy=x^3y-20x$ intersects the curve with equation $y=\frac{1}{x}$. Give each of your answers in the form $a+b\sqrt{c}$, where a and b are rational and c is the smallest integer possible. [6]

View solution

5 There are 3 women, 2 men and 4 children in a choir.

(a) The choir stands in a single straight line.

View solution

(i) Find the number of possible arrangements if the first person and last person are both women. [2]

(ii) Find the number of possible arrangements if all the children stand next to each other. [2]

View solution

(b) Four of the choir are selected to sing in a group.

View solution

(i) Find the number of different selections if no man is chosen. [2]

(ii) Find the number of different selections if at least 2 women are chosen. [2]

View solution

6 Variables x and y are such that $y = \cos x \sin^2 x$. Use differentiation to find the approximate change in y as x increases from 3 to $3 + h$, where h is small. [5]

View solution

7 It is given that $y = mx^2 + \frac{x}{2} + n$, where m and n are non-zero constants. It is also given that $3\left(\frac{\mathrm{d}^2y}{\mathrm{d}x^2}\right) = \left(\frac{\mathrm{d}y}{\mathrm{d}x}\right)^2 - y$ for all values of x. Find the values of m and n. [4]

View solution

8 **(a)** In an arithmetic progression, the sum of the first 30 terms is -1065.
The sum of the **next** 20 terms is -2210.
Find the first term and the common difference. [5]

View solution

(b) A geometric progression is such that the first term is 4 and the sum of the first three terms is 7.

Find the two possible values of the common ratio and find the sum to infinity for the convergent progression. [5]

View solution

9 The functions f and g are defined by

$$\mathrm{f}(x) = \frac{3x^2}{4x-1} \quad \text{for } x < 0$$
$$\mathrm{g}(x) = \frac{1}{x^2} \quad \text{for } x < 0.$$

(a) Explain why the function fg does **not** exist. [1]

View solution

(b) Given that the function gf does exist, find and simplify an expression for $\mathrm{gf}(x)$. [2]

View solution

(c) Show that $\mathrm{f}^{-1}(x)$ can be written as $\frac{px-\sqrt{x(qx+r)}}{3}$ where p, q and r are integers. [4]

View solution

10 **(a)** Show that $(\tan x + \sec x)^2$ can be written as $\dfrac{1+\sin x}{1-\sin x}$. [4]

View solution

(b) Hence solve the equation $(\tan 3\theta + \sec 3\theta)^2 = 6$ for $0° \leqslant \theta \leqslant 180°$. [4]

View solution

11 In this question all lengths are in centimetres.

View solution

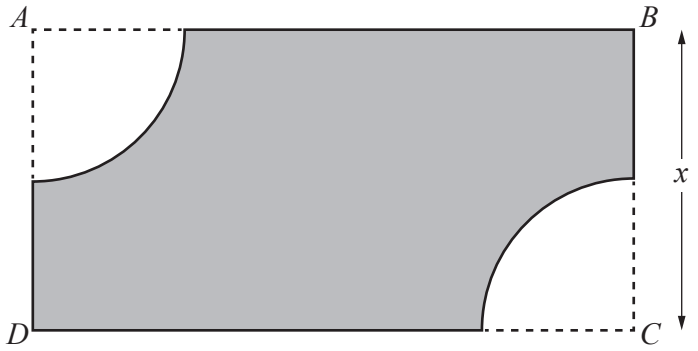

The diagram shows a rectangle $ABCD$ with $BC = x$.
The area of the rectangle is $400\ \text{cm}^2$.

Two identical quarter-circles of radius $\frac{x}{2}$, with centres A and C, are removed from the rectangle to make the shaded shape.

Given that x can vary, find the value of x that gives the minimum value of the perimeter of the shaded shape and hence find this minimum value. [7]

© UCLES 2024

Continuation of working space for Question 11.

© UCLES 2024

12

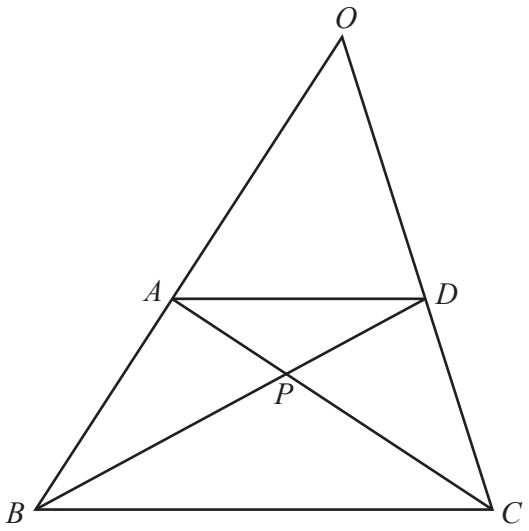

The diagram shows a triangle OBC.
$OA : OB = 4 : 7$ and $OD : OC = 4 : 7$.

$$\overrightarrow{OB} = \mathbf{b} \text{ and } \overrightarrow{OC} = \mathbf{c}$$

The point P is the point of intersection of AC and BD such that $\overrightarrow{AP} = \lambda\overrightarrow{AC}$ and $\overrightarrow{BP} = \mu\overrightarrow{BD}$ where λ and μ are scalars.

(a) Find two expressions for $\overrightarrow{OP}$, each in terms of **b**, **c** and a scalar, and hence show that P divides both AC and DB in the ratio 4 : 7. [7]

View solution

(b) The point Q is such that $\overrightarrow{OQ} = \frac{2}{7}\mathbf{b} + \frac{2}{7}\mathbf{c}$.

View solution

Use a vector method to show that O, Q and P are collinear. Justify your answer. [2]

BLANK PAGE

Permission to reproduce items where third-party owned material protected by copyright is included has been sought and cleared where possible. Every reasonable effort has been made by the publisher (UCLES) to trace copyright holders, but if any items requiring clearance have unwittingly been included, the publisher will be pleased to make amends at the earliest possible opportunity.

To avoid the issue of disclosure of answer-related information to candidates, all copyright acknowledgements are reproduced online in the Cambridge Assessment International Education Copyright Acknowledgements Booklet. This is produced for each series of examinations and is freely available to download at www.cambridgeinternational.org after the live examination series.

Cambridge Assessment International Education is part of Cambridge Assessment. Cambridge Assessment is the brand name of the University of Cambridge Local Examinations Syndicate (UCLES), which is a department of the University of Cambridge.

© UCLES 2024