Cambridge Assessment International Education

Cambridge IGCSE™

CANDIDATE NAME									
CENTRE NUMBER						CANDIDATE NUMBER			

ADDITIONAL MATHEMATICS **0606/12**

Paper 1 Non-calculator **May/June 2025**

2 hours

You must answer on the question paper.

No additional materials are needed.

INSTRUCTIONS

- Answer **all** questions.
- Use a black or dark blue pen. You may use an HB pencil for any diagrams or graphs.
- Write your name, centre number and candidate number in the boxes at the top of the page.
- Write your answer to each question in the space provided.
- Do **not** use an erasable pen or correction fluid.
- Do **not** write on any bar codes.
- Calculators must **not** be used in this paper.
- You must show all necessary working clearly.

INFORMATION

- The total mark for this paper is 80.
- The number of marks for each question or part question is shown in brackets [ ].

This document has **16** pages.

© UCLES 2025

List of formulas

Equation of a circle with centre (a, b) and radius r. $(x-a)^2 + (y-b)^2 = r^2$

Curved surface area, A, of cone of radius r, sloping edge l. $A = \pi rl$

Surface area, A, of sphere of radius r. $A = 4\pi r^2$

Volume, V, of pyramid or cone, base area A, height h. $V = \frac{1}{3}Ah$

Volume, V, of sphere of radius r. $V = \frac{4}{3}\pi r^3$

Quadratic equation

For the equation $ax^2 + bx + c = 0$,

$$x = \frac{-b \pm \sqrt{b^2 - 4ac}}{2a}$$

Binomial theorem

$$(a+b)^n = a^n + \binom{n}{1}a^{n-1}b + \binom{n}{2}a^{n-2}b^2 + \ldots + \binom{n}{r}a^{n-r}b^r + \ldots + b^n,$$

where n is a positive integer and $\binom{n}{r} = \frac{n!}{(n-r)!r!}$

Arithmetic series

$$u_n = a + (n-1)d$$

$$S_n = \frac{1}{2}n(a+l) = \frac{1}{2}n\{2a + (n-1)d\}$$

Geometric series

$$u_n = ar^{n-1}$$

$$S_n = \frac{a(1-r^n)}{1-r} \quad (r \neq 1)$$

$$S_\infty = \frac{a}{1-r} \quad (|r| < 1)$$

Identities

$$\sin^2 A + \cos^2 A = 1$$

$$\sec^2 A = 1 + \tan^2 A$$

$$\operatorname{cosec}^2 A = 1 + \cot^2 A$$

Formulas for ΔABC

$$\frac{a}{\sin A} = \frac{b}{\sin B} = \frac{c}{\sin C}$$

$$a^2 = b^2 + c^2 - 2bc\cos A$$

$$\Delta = \frac{1}{2}ab\sin C$$

© UCLES 2025



Calculators must **not** be used in this paper.

View solution

1

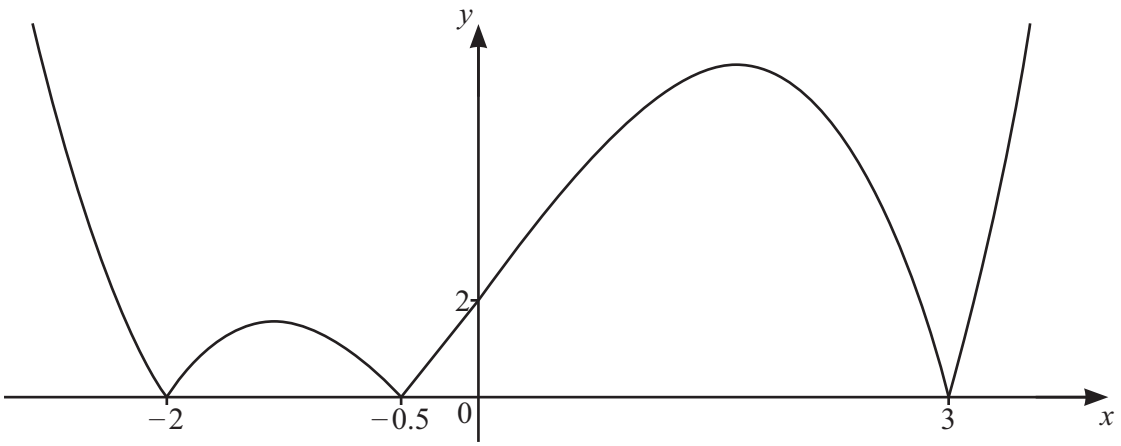

The diagram shows the graph of $y = |f(x)|$, where f is a cubic polynomial.
Find expressions for the two possible functions $f(x)$.
Write each expression in fully factorised form. [3]

2 Solve the equation $x^{\frac{1}{3}} + 1 = \dfrac{6}{x^{\frac{1}{3}}}$. [4]

View solution

3 A circle with centre C has the equation $x^2 + y^2 - 10x - 4y + 24 = 0$.

(a) Show that the line $y = 2x - 3$ is a tangent to this circle. [3]

View solution

(b) Given that this tangent touches the circle at the point P, find the coordinates of P. [2]

View solution

(c) Find the equation of the circle which has its centre at P and passes through the origin. [3]

View solution

© UCLES 2025

4 **(a)** Find $\int_0^{\pi} \sin\theta \, d\theta$. [2]

View solution

(b) Given that $0 < \alpha < \frac{\pi}{2}$, show that $\frac{\sec\alpha}{\cot\alpha + \tan\alpha}$ can be written as $\sin\alpha$. [3]

View solution

5 The polynomial p is such that $\mathrm{p}(x) = 3x^3 - 7x^2 + ax + b$, where a and b are integers.

It is given that $\mathrm{p}'(-1) = 21$ and that $x - 2$ is a factor of $\mathrm{p}(x)$.

(a) Find the values of a and b. [4]

View solution

(b) Hence write $\mathrm{p}(x)$ as a product of linear factors with integer coefficients. [3]

View solution

(c) Using your values of a and b, solve the equation $3\mathrm{e}^{6y} - 7\mathrm{e}^{4y} + a\mathrm{e}^{2y} + b = 0$. [3]

View solution

© UCLES 2025

6 When $\ln y$ is plotted against x^3, a straight line passing through the points $(2, 5)$ and $(-8, 25)$ is obtained.

(a) Find y in terms of x. [4]

View solution

(b) Find the value of x when $y = e^{25}$. [2]

View solution

7 A geometric progression has a 4th term of $\frac{8k^6}{27}$ and a 6th term of $\frac{32k^{10}}{243}$, where k is a constant.

The common ratio of this geometric progression is positive.

(a) Find the common ratio in terms of k and the value of the first term of this geometric progression. [4]

View solution

(b) Given that this geometric progression has a sum to infinity of 3, find the possible values of k. [3]

View solution

8 It is given that $y = \dfrac{\ln(3x^2 + 16)}{x + 2}$.

(a) Find $\dfrac{\mathrm{d}y}{\mathrm{d}x}$ when $x = 0$.

View solution

Give your answer in the form $\ln p$, where p is a constant. [5]

(b) Given that x increases from 0 to h, where h is small, write down the approximate change in y. [1]

View solution

© UCLES 2025

9 It is given that $\mathrm{f}(x) = 2\ln(3x-4)$, for $x > a$, and that f^{-1} exists.

(a) Find the least possible value of a. [1]

View solution

(b) For your value of a, find the range of f. [1]

View solution

(c) For your value of a, find an expression for $\mathrm{f}^{-1}(x)$. [2]

View solution

(d) It is given that the equation $\mathrm{f}(x) = \mathrm{f}^{-1}(x)$ has two roots.

View solution

For your value of a, sketch the graphs of $y = \mathrm{f}(x)$ and $y = \mathrm{f}^{-1}(x)$ on the axes.

Label each graph.
State the intercepts of each graph with the axes.
State the equations of any asymptotes. [4]

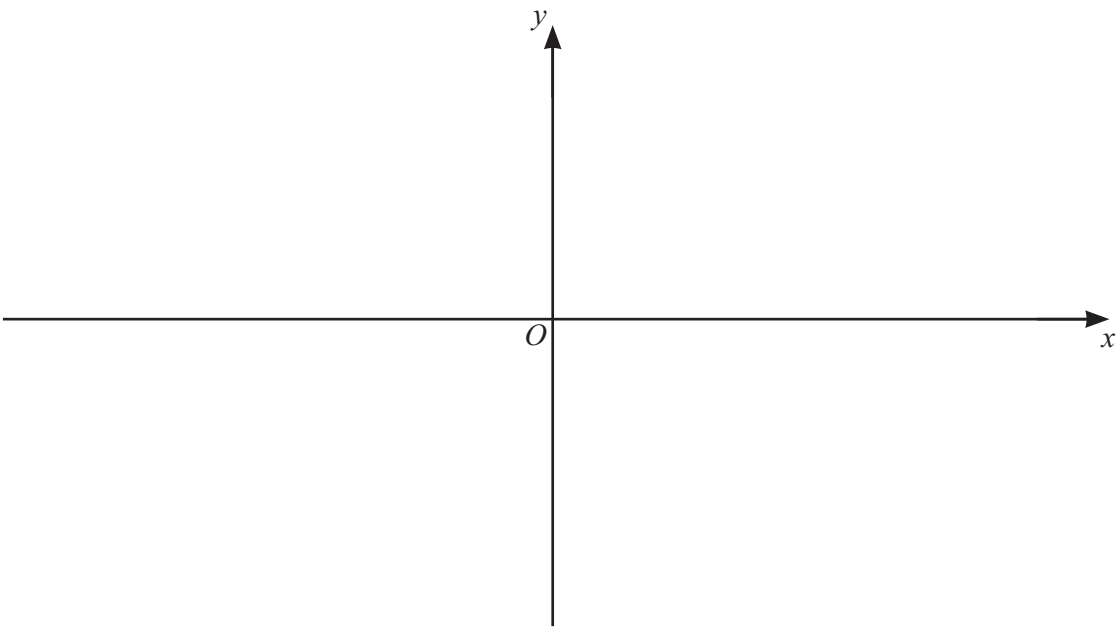

10

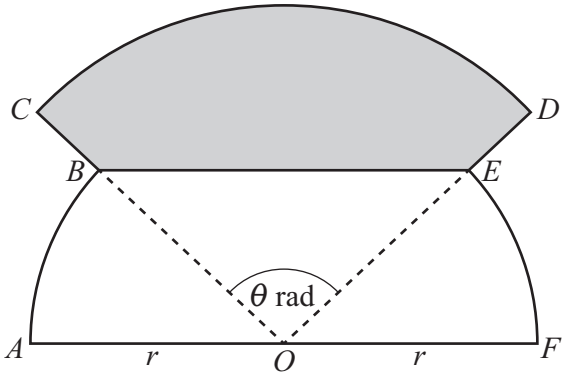

The diagram shows the shape $OABCDEF$.
AOF is a straight line.
OAB and OEF are sectors of a circle with centre O and radius r.
Angle BOA = angle EOF.

OCD is a sector of a circle with centre O and radius $\frac{4r}{3}$.

Angle COD is θ radians.
The point B lies on the line OC and the point E lies on the line OD.
The line BE is parallel to the line AOF.

(a) Find, in terms of r and θ, the area of the shaded region $BCDE$. [3]

View solution

(b)

View solution

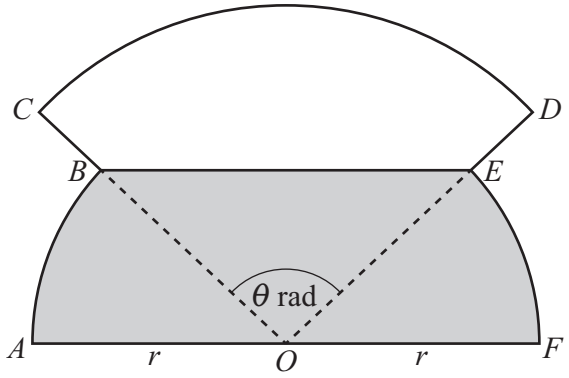

The diagram shows the shape from part **(a)** with region *OABEF* shaded.
Find, in terms of r and θ, the perimeter of the shaded region. [5]

11

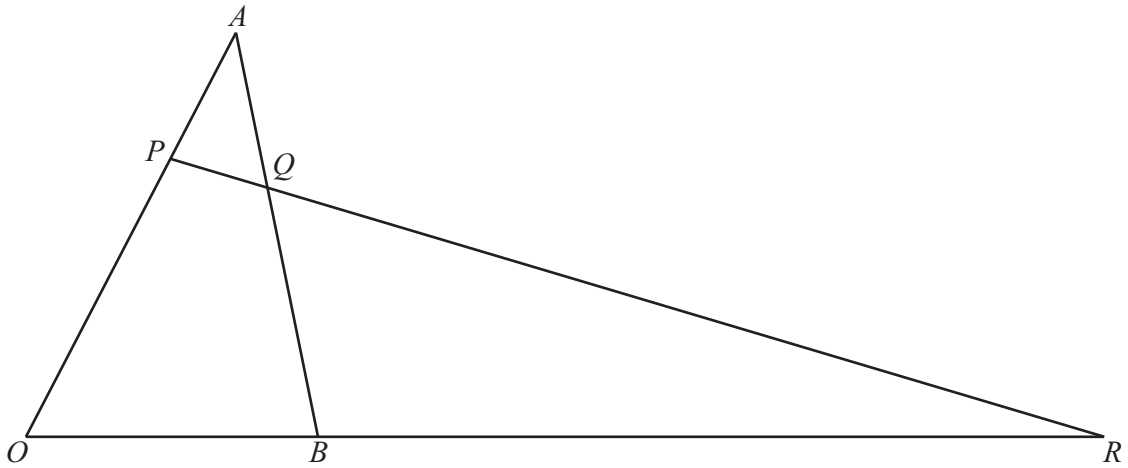

The diagram shows the triangle OAB, where $\overrightarrow{OA} = \mathbf{a}$ and $\overrightarrow{OB} = \mathbf{b}$.

The point P lies on OA such that $\overrightarrow{OP} = \frac{3}{4}\overrightarrow{OA}$.

The point Q lies on AB such that $\overrightarrow{AQ} = \frac{1}{3}\overrightarrow{AB}$.

The straight line through P and Q meets the straight line through O and B at the point R.
It is given that $\overrightarrow{OR} = \lambda\mathbf{b}$ and $\overrightarrow{PR} = \mu\overrightarrow{PQ}$, where λ and μ are constants.

(a) Find $\overrightarrow{OR}$ in terms of $\mathbf{a}$, $\mathbf{b}$ and μ. [6]

View solution

© UCLES 2025

(b) Hence find the values of λ and μ. [3]

View solution

Question 12 is printed on the next page.

12 A curve is such that its gradient at the point (x, y) is given by $(5x-2)^{\frac{1}{3}}$.

The curve passes through the point $\left(2, \frac{32}{5}\right)$.

Find the coordinates of the stationary point on the curve. [6]

View solution

Permission to reproduce items where third-party owned material protected by copyright is included has been sought and cleared where possible. Every reasonable effort has been made by the publisher (UCLES) to trace copyright holders, but if any items requiring clearance have unwittingly been included, the publisher will be pleased to make amends at the earliest possible opportunity.

To avoid the issue of disclosure of answer-related information to candidates, all copyright acknowledgements are reproduced online in the Cambridge Assessment International Education Copyright Acknowledgements Booklet. This is produced for each series of examinations and is freely available to download at www.cambridgeinternational.org after the live examination series.

Cambridge Assessment International Education is part of Cambridge Assessment. Cambridge Assessment is the brand name of the University of Cambridge Local Examinations Syndicate (UCLES), which is a department of the University of Cambridge.

© UCLES 2025