Cambridge Assessment International Education

Cambridge IGCSE™

CANDIDATE NAME									
CENTRE NUMBER						CANDIDATE NUMBER				

ADDITIONAL MATHEMATICS **0606/13**

Paper 1 Non-calculator **May/June 2025**

2 hours

You must answer on the question paper.

No additional materials are needed.

INSTRUCTIONS

- Answer **all** questions.
- Use a black or dark blue pen. You may use an HB pencil for any diagrams or graphs.
- Write your name, centre number and candidate number in the boxes at the top of the page.
- Write your answer to each question in the space provided.
- Do **not** use an erasable pen or correction fluid.
- Do **not** write on any bar codes.
- Calculators must **not** be used in this paper.
- You must show all necessary working clearly.

INFORMATION

- The total mark for this paper is 80.
- The number of marks for each question or part question is shown in brackets [ ].

This document has **16** pages.

© UCLES 2025

List of formulas

Equation of a circle with centre (a, b) and radius r. $(x-a)^2 + (y-b)^2 = r^2$

Curved surface area, A, of cone of radius r, sloping edge l. $A = \pi rl$

Surface area, A, of sphere of radius r. $A = 4\pi r^2$

Volume, V, of pyramid or cone, base area A, height h. $V = \frac{1}{3}Ah$

Volume, V, of sphere of radius r. $V = \frac{4}{3}\pi r^3$

Quadratic equation

For the equation $ax^2 + bx + c = 0$,

$$x = \frac{-b \pm \sqrt{b^2 - 4ac}}{2a}$$

Binomial theorem

$$(a+b)^n = a^n + \binom{n}{1}a^{n-1}b + \binom{n}{2}a^{n-2}b^2 + \ldots + \binom{n}{r}a^{n-r}b^r + \ldots + b^n,$$

where n is a positive integer and $\binom{n}{r} = \frac{n!}{(n-r)!r!}$

Arithmetic series

$$u_n = a + (n-1)d$$
$$S_n = \frac{1}{2}n(a+l) = \frac{1}{2}n\{2a + (n-1)d\}$$

Geometric series

$$u_n = ar^{n-1}$$
$$S_n = \frac{a(1-r^n)}{1-r} \quad (r \neq 1)$$
$$S_\infty = \frac{a}{1-r} \quad (|r| < 1)$$

Identities

$$\sin^2 A + \cos^2 A = 1$$
$$\sec^2 A = 1 + \tan^2 A$$
$$\operatorname{cosec}^2 A = 1 + \cot^2 A$$

Formulas for ΔABC

$$\frac{a}{\sin A} = \frac{b}{\sin B} = \frac{c}{\sin C}$$
$$a^2 = b^2 + c^2 - 2bc\cos A$$
$$\Delta = \frac{1}{2}ab\sin C$$

© UCLES 2025



Calculators must **not** be used in this paper.

View solution

1 (a)

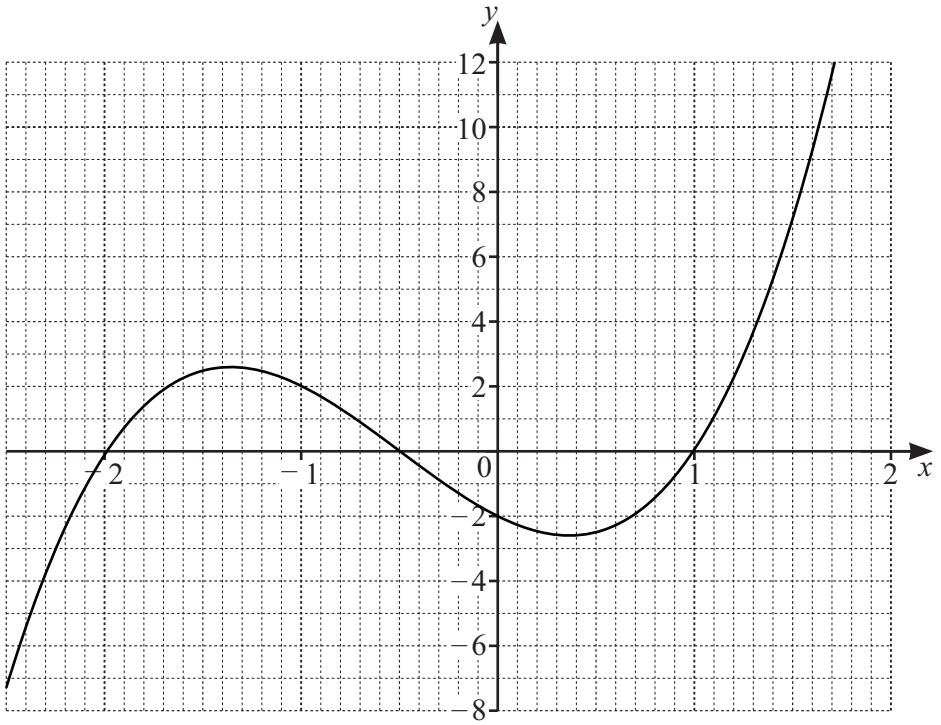

The diagram shows the graph of $y = (2x + a)(x + b)(x + c)$ where a, b and c are integers.

Find values for a, b and c. [2]

(b) Use the graph to find the values of x for which $y \geqslant 2$. [3]

View solution

2 Find the values of k for which the equation $x^2 + 4kx + k + 3 = 0$ has two equal roots. [4]

View solution

3 The polynomial p is such that $\mathrm{p}(x) = x^3 + Ax + 30$, where A is a constant.
When $\mathrm{p}(x)$ is divided by $x + 2$ the remainder is 84.

View solution

Write $\mathrm{p}(x)$ as a product of linear factors. [5]

© UCLES 2025

4 Solve the equation $\frac{2}{\log_x 10} - \lg(x+4) = \lg 2$ for $x > 0$. [5]

View solution

5 Solutions by accurate drawing will not be accepted.

A circle, C, has equation $(x-5)^2+(y-12)^2=100$.

(a) Find the equation of the tangent to C at the point (11, 4).
Give your answer in the form $ax+by=c$, where a, b and c are integers. [4]

View solution

(b) Show that C and the circle with equation $x^2+y^2=4$ do not intersect. [2]

View solution

6 Find the x-coordinates of the points of intersection of the following curves.

View solution

$$y = 4\ln x \quad \text{and} \quad y = 5 - \frac{3}{\ln\left(x^2\right)}$$

Give your answers in exact form. [5]

7 In this question, all lengths are in centimetres and all angles are in radians.

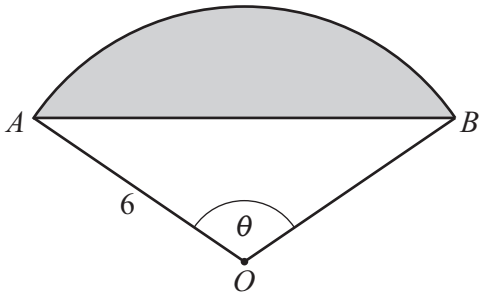

The diagram shows a sector of a circle with centre O and radius 6.

(a) It is given that the area of triangle AOB is $9\,\text{cm}^2$.

View solution

Find the value of $\sin\theta$. [2]

(b) It is also given that the exact area of the shaded segment is $(15\pi - 9)\,\text{cm}^2$.

View solution

Find the exact length of the arc AB. [4]

8

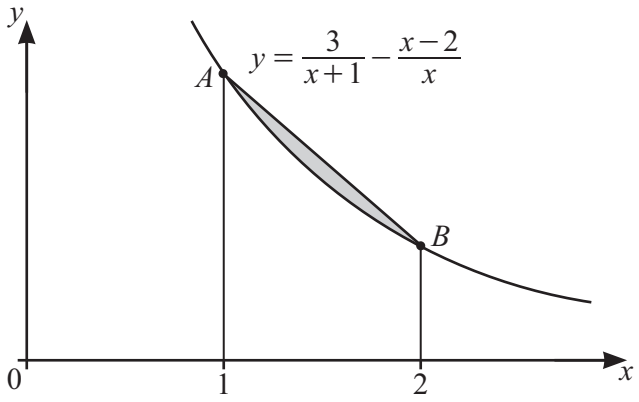

The diagram shows part of the curve $y = \frac{3}{x+1} - \frac{x-2}{x}$.

The points A and B lie on the curve such that the x-coordinate of A is 1 and the x-coordinate of B is 2.

(a) Find the y-coordinates of A and B. [1]

View solution

(b) Show that the area of the shaded region enclosed by the line AB and the curve is $\frac{a}{4} - \ln\frac{b}{2}$, where a and b are integers to be found. [7]

View solution

9 The function f is defined by $\mathrm{f}(x) = -2x^2 + 9x - 10$ for $0 \leqslant x \leqslant 3$.

(a) (i) Write $\mathrm{f}(x)$ in the form $a + b(x + c)^2$ where a, b and c are constants. [3]

View solution

(ii) Hence determine whether or not f^{-1} exists. [2]

View solution

(b) The function g is defined by $g(x) = 3\ln(5-2x)$ for $0 \leqslant x < 2.5$.

View solution

(i) On the axes, sketch the graph of $y = g(x)$.
State the exact values of the intercepts with the coordinate axes and the equation of any asymptote. [3]

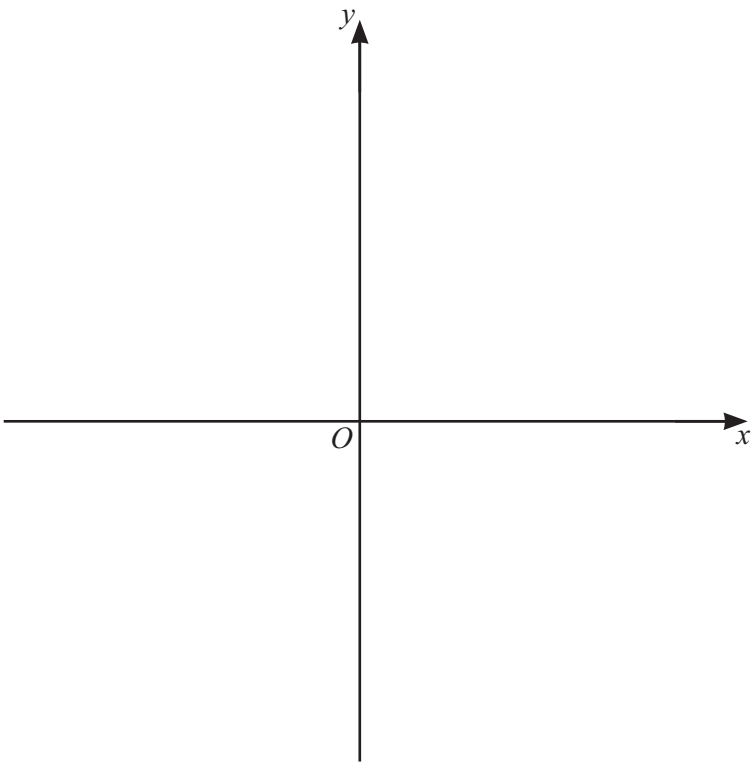

(ii) Find an expression for $g^{-1}(x)$. [2]

View solution

(iii) Find the domain and range of g^{-1}.
Give each of your answers in exact form. [2]

View solution

10

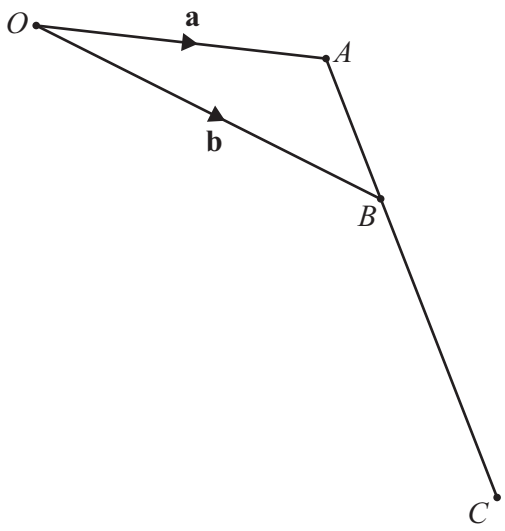

The diagram shows four points, O, A, B and C.

A, B and C lie in a straight line and are such that $\frac{AB}{AC} = \frac{1}{3}$.

$\overrightarrow{OA} = \mathbf{a}$ and $\overrightarrow{OB} = \mathbf{b}$.

(a) Find $\overrightarrow{OC}$ in terms of **a** and **b**.
Simplify your answer. [3]

View solution

(b) The line OA is extended to the point D such that $OA : AD = 2 : 7$.
Point E lies on CD such that $\overrightarrow{OE} = \lambda\mathbf{b}$.

View solution

Find the value of λ. [5]

11 A particle P moves in a straight line and passes through a fixed point O.
At time t seconds, its displacement from O, s metres, is given by

$$s = t + 6t^2 - t^3 \qquad \text{for } 0 \leqslant t \leqslant 3$$

$$s = 12t - \frac{1}{3}t^2 - 3 \qquad \text{for } 3 \leqslant t \leqslant k \qquad \text{where } k \text{ is a constant.}$$

It is given that, for $3 \leqslant t \leqslant k$, the velocity of P is positive and its acceleration is negative.

(a) The maximum velocity of P occurs when $t = 2$.
On the axes below, sketch a velocity–time graph for the first k seconds of the motion of P. [4]

View solution

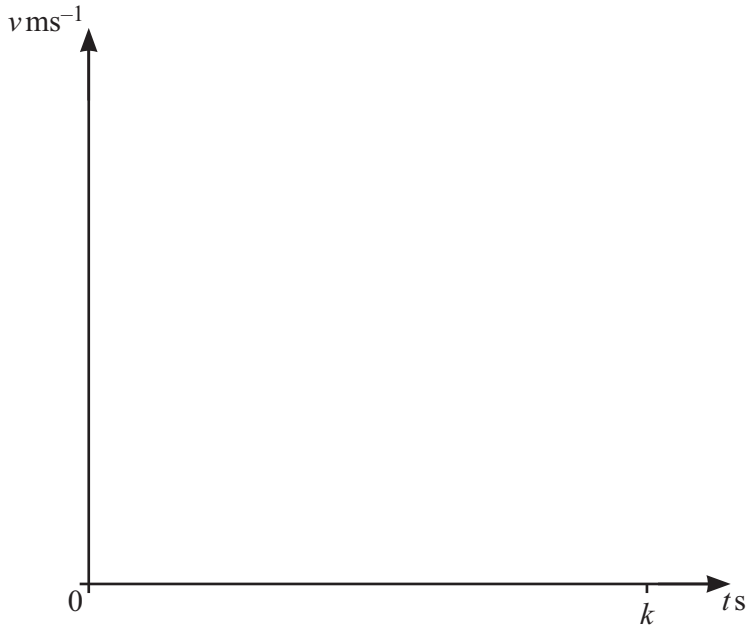

(b) The total distance travelled by P for $0 \leqslant t \leqslant k$ is 57 metres.

Given that when $t = 3$ the distance and displacement of P from O are equal, find the value of k. [6]

View solution

Question 12 is printed on the next page.

12 The normal to the curve $y = \frac{4}{x^2} + ax + 7$ at the point where $x = 2$ has equation $x + 4y = b$.

Find the values of a and b. [6]

View solution

Permission to reproduce items where third-party owned material protected by copyright is included has been sought and cleared where possible. Every reasonable effort has been made by the publisher (UCLES) to trace copyright holders, but if any items requiring clearance have unwittingly been included, the publisher will be pleased to make amends at the earliest possible opportunity.

To avoid the issue of disclosure of answer-related information to candidates, all copyright acknowledgements are reproduced online in the Cambridge Assessment International Education Copyright Acknowledgements Booklet. This is produced for each series of examinations and is freely available to download at www.cambridgeinternational.org after the live examination series.

Cambridge Assessment International Education is part of Cambridge Assessment. Cambridge Assessment is the brand name of the University of Cambridge Local Examinations Syndicate (UCLES), which is a department of the University of Cambridge.

© UCLES 2025