Cambridge IGCSE

Cambridge International Examinations
Cambridge International General Certificate of Secondary Education

CANDIDATE NAME									
CENTRE NUMBER						CANDIDATE NUMBER				

ADDITIONAL MATHEMATICS **0606/13**

Paper 1 **October/November 2014**

2 hours

Candidates answer on the Question Paper.

Additional Materials: Electronic calculator

READ THESE INSTRUCTIONS FIRST

Write your Centre number, candidate number and name on all the work you hand in.
Write in dark blue or black pen.
You may use an HB pencil for any diagrams or graphs.
Do not use staples, paper clips, glue or correction fluid.
DO **NOT** WRITE IN ANY BARCODES.

Answer **all** the questions.
Give non-exact numerical answers correct to 3 significant figures, or 1 decimal place in the case of angles in degrees, unless a different level of accuracy is specified in the question.
The use of an electronic calculator is expected, where appropriate.
You are reminded of the need for clear presentation in your answers.

At the end of the examination, fasten all your work securely together.
The number of marks is given in brackets [ ] at the end of each question or part question.
The total number of marks for this paper is 80.

This document consists of **15** printed pages and **1** blank page.

© UCLES 2014

CAMBRIDGE International Examinations

Mathematical Formulae

1. ALGEBRA

Quadratic Equation

For the equation $ax^2 + bx + c = 0$,

$$x = \frac{-b \pm \sqrt{b^2 - 4ac}}{2a}.$$

Binomial Theorem

$$(a + b)^n = a^n + \binom{n}{1} a^{n-1} b + \binom{n}{2} a^{n-2} b^2 + \ldots + \binom{n}{r} a^{n-r} b^r + \ldots + b^n,$$

where n is a positive integer and $\binom{n}{r} = \frac{n!}{(n-r)!r!}$.

2. TRIGONOMETRY

Identities

$$\sin^2 A + \cos^2 A = 1$$

$$\sec^2 A = 1 + \tan^2 A$$

$$\operatorname{cosec}^2 A = 1 + \cot^2 A$$

Formulae for ΔABC

$$\frac{a}{\sin A} = \frac{b}{\sin B} = \frac{c}{\sin C}$$

$$a^2 = b^2 + c^2 - 2bc \cos A$$

$$\Delta = \frac{1}{2} bc \sin A$$

© UCLES 2014

1 The diagram shows the graph of $y = a\cos bx + c$ for $0° \leqslant x \leqslant 360°$, where a, b and c are positive integers.

View solution

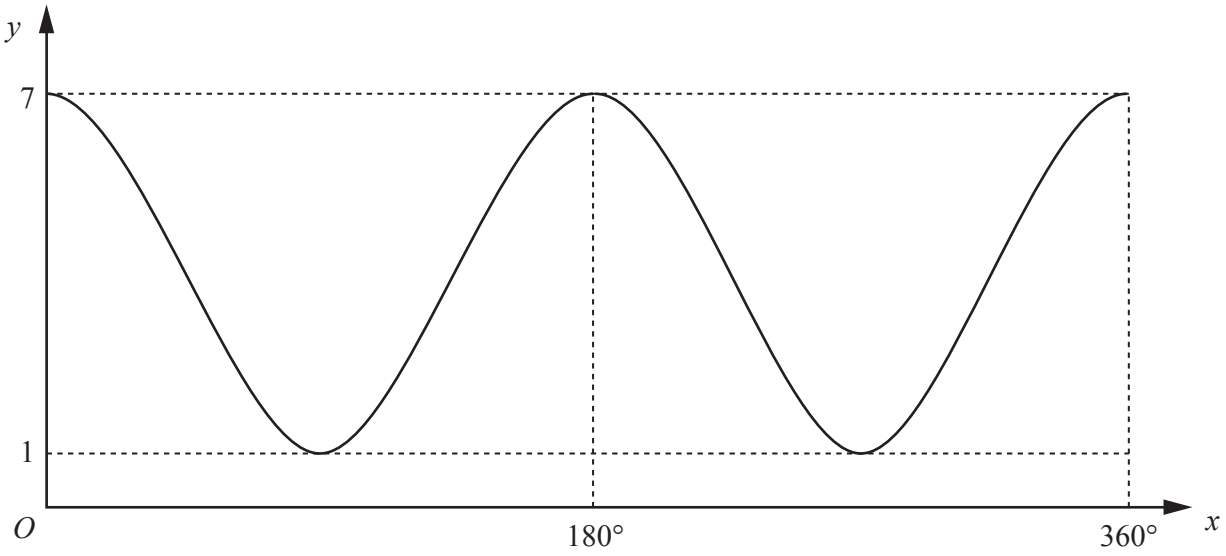

State the value of each of a, b and c. [3]

$a =$

$b =$

$c =$

2 The line $4y = x + 8$ cuts the curve $xy = 4 + 2x$ at the points A and B. Find the exact length of AB. [5]

View solution

3 The universal set $\mathscr{E}$ is the set of real numbers. Sets A, B and C are such that

$$A = \{x : x^2 + 5x + 6 = 0\},$$

$$B = \{x : (x - 3)(x + 2)(x + 1) = 0\},$$

$$C = \{x : x^2 + x + 3 = 0\}.$$

(i) State the value of each of n(A), n(B) and n(C). [3]

View solution

$\mathrm{n}(A) =$

$\mathrm{n}(B) =$

$\mathrm{n}(C) =$

(ii) List the elements in the set $A \cup B$. [1]

View solution

(iii) List the elements in the set $A \cap B$. [1]

View solution

(iv) Describe the set C'. [1]

View solution

© UCLES 2014

4 **(a)** Solve $3\sin x + 5\cos x = 0$ for $0° \leqslant x \leqslant 360°$. [3]

View solution

(b) Solve $\operatorname{cosec}\left(3y + \frac{\pi}{4}\right) = 2$ for $0 \leqslant y \leqslant \pi$ radians. [5]

View solution

© UCLES 2014

5 **(a)** A drinks machine sells coffee, tea and cola. Coffee costs \$0.50, tea costs \$0.40 and cola costs \$0.45. The table below shows the numbers of drinks sold over a 4-day period.

View solution

	Coffee	Tea	Cola
Tuesday	12	2	1
Wednesday	9	3	0
Thursday	8	5	1
Friday	11	2	0

(i) Write down 2 matrices whose product will give the amount of money the drinks machine took each day and evaluate this product. [4]

(ii) Hence write down the total amount of money taken by the machine for this 4-day period. [1]

View solution

(b) Matrices **X** and **Y** are such that $\mathbf{X} = \begin{pmatrix} 2 & 4 \\ -5 & 1 \end{pmatrix}$ and $\mathbf{XY} = \mathbf{I}$, where **I** is the identity matrix. Find the matrix **Y**. [3]

View solution

© UCLES 2014

6 The diagram shows a sector, AOB, of a circle centre O, radius 12 cm. Angle $AOB = 0.9$ radians. The point C lies on OA such that $OC = CB$.

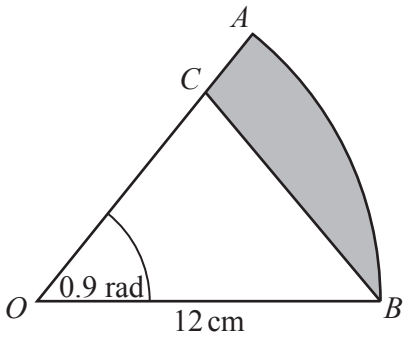

(i) Show that $OC = 9.65$ cm correct to 3 significant figures. [2]

View solution

(ii) Find the perimeter of the shaded region. [3]

View solution

(iii) Find the area of the shaded region. [3]

View solution

---

7 Solve the equation $1 + 2\log_5 x = \log_5(18x - 9)$. [5]

View solution

---

8 **(i)** Given that $f(x) = x \ln x^3$, show that $f'(x) = 3(1 + \ln x)$. [3]

View solution

(ii) Hence find $\int (1 + \ln x)\,dx$. [2]

View solution

(iii) Hence find $\int_1^2 \ln x\,dx$ in the form $p + \ln q$, where p and q are integers. [3]

View solution

9 **(a)** Given that the first 3 terms in the expansion of $(5 - qx)^p$ are $625 - 1500x + rx^2$, find the value of each of the integers p, q and r. [5]

View solution

(b) Find the value of the term that is independent of x in the expansion of $\left(2x + \frac{1}{4x^3}\right)^{12}$. [3]

View solution

10 (a) Solve the following simultaneous equations.

View solution

$$\frac{5^x}{25^{3y-2}} = 1$$

$$\frac{3^x}{27^{y-1}} = 81$$

[5]

© UCLES 2014

(b) The diagram shows a triangle ABC such that $AB = (2 + \sqrt{3})$ cm, $BC = (1 + 2\sqrt{3})$ cm and $AC = 2$ cm.

View solution

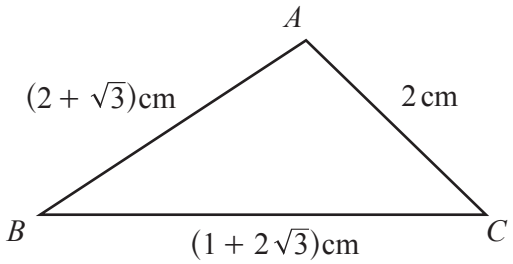

Without using a calculator, find the value of $\cos A$ in the form $a + b\sqrt{3}$, where a and b are constants to be found. [4]

11 The diagram shows part of the curve $y = (x + 5)(x - 1)^2$.

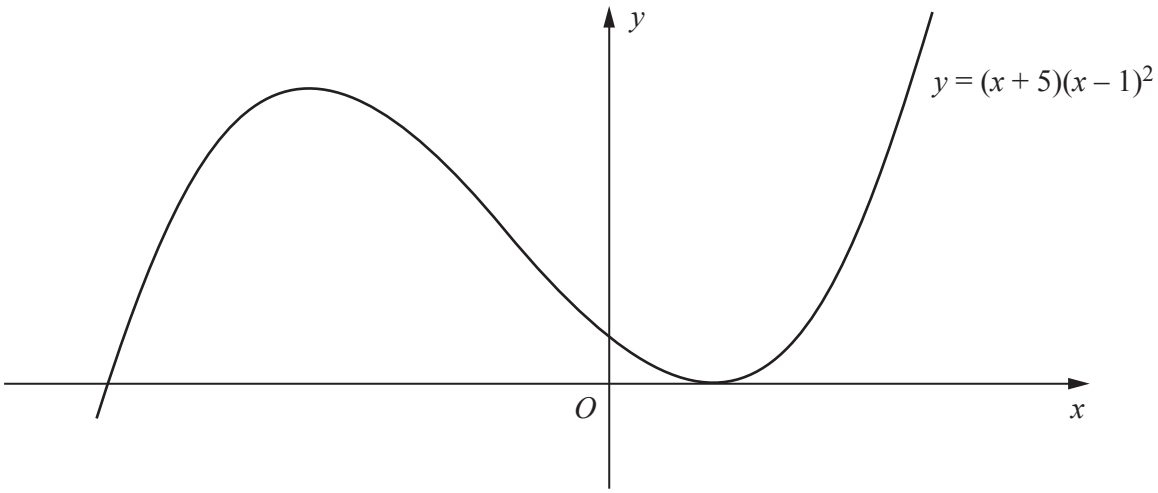

(i) Find the x-coordinates of the stationary points of the curve. [5]

View solution

(ii) Find $\int (x+5)(x-1)^2 \, \mathrm{d}x$. [3]

View solution

(iii) Hence find the area enclosed by the curve and the x-axis. [2]

View solution

(iv) Find the set of positive values of k for which the equation $(x+5)(x-1)^2 = k$ has only one real solution. [2]

View solution

© UCLES 2014

BLANK PAGE

Permission to reproduce items where third-party owned material protected by copyright is included has been sought and cleared where possible. Every reasonable effort has been made by the publisher (UCLES) to trace copyright holders, but if any items requiring clearance have unwittingly been included, the publisher will be pleased to make amends at the earliest possible opportunity.

Cambridge International Examinations is part of the Cambridge Assessment Group. Cambridge Assessment is the brand name of University of Cambridge Local Examinations Syndicate (UCLES), which is itself a department of the University of Cambridge.

© UCLES 2014