Cambridge IGCSE

Cambridge International Examinations
Cambridge International General Certificate of Secondary Education

CANDIDATE NAME	
CENTRE NUMBER	
CANDIDATE NUMBER	

ADDITIONAL MATHEMATICS **0606/11**

Paper 1 **October/November 2017**

2 hours

Candidates answer on the Question Paper.

Additional Materials: Electronic calculator

READ THESE INSTRUCTIONS FIRST

Write your Centre number, candidate number and name on all the work you hand in.
Write in dark blue or black pen.
You may use an HB pencil for any diagrams or graphs.
Do not use staples, paper clips, glue or correction fluid.
DO **NOT** WRITE IN ANY BARCODES.

Answer **all** the questions.
Give non-exact numerical answers correct to 3 significant figures, or 1 decimal place in the case of angles in degrees, unless a different level of accuracy is specified in the question.
The use of an electronic calculator is expected, where appropriate.
You are reminded of the need for clear presentation in your answers.

At the end of the examination, fasten all your work securely together.
The number of marks is given in brackets [ ] at the end of each question or part question.
The total number of marks for this paper is 80.

This document consists of **16** printed pages.

© UCLES 2017

Mathematical Formulae

1. ALGEBRA

Quadratic Equation

For the equation $ax^2 + bx + c = 0$,

$$x = \frac{-b \pm \sqrt{b^2 - 4ac}}{2a}.$$

Binomial Theorem

$$(a + b)^n = a^n + \binom{n}{1} a^{n-1} b + \binom{n}{2} a^{n-2} b^2 + \ldots + \binom{n}{r} a^{n-r} b^r + \ldots + b^n,$$

where n is a positive integer and $\binom{n}{r} = \frac{n!}{(n-r)!r!}$.

2. TRIGONOMETRY

Identities

$$\sin^2 A + \cos^2 A = 1$$

$$\sec^2 A = 1 + \tan^2 A$$

$$\operatorname{cosec}^2 A = 1 + \cot^2 A$$

Formulae for ΔABC

$$\frac{a}{\sin A} = \frac{b}{\sin B} = \frac{c}{\sin C}$$

$$a^2 = b^2 + c^2 - 2bc \cos A$$

$$\Delta = \frac{1}{2} bc \sin A$$

© UCLES 2017

1 Express in set notation the shaded regions shown in the Venn diagrams below.

View solution

(i)

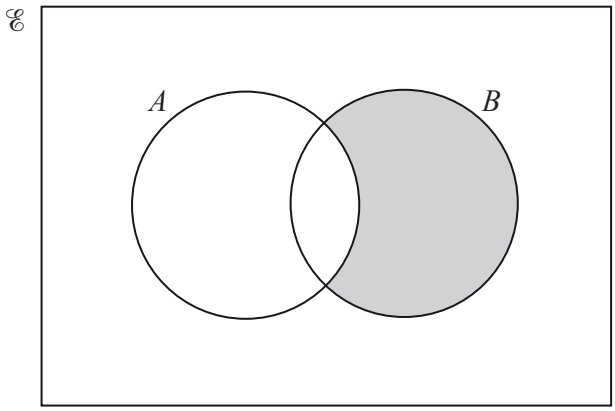

..... [1]

View solution

(ii)

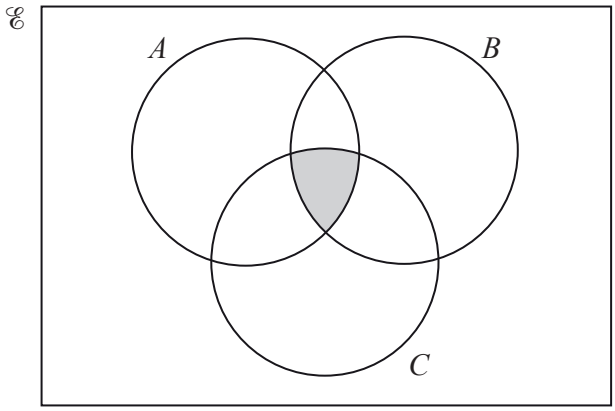

..... [1]

View solution

(iii)

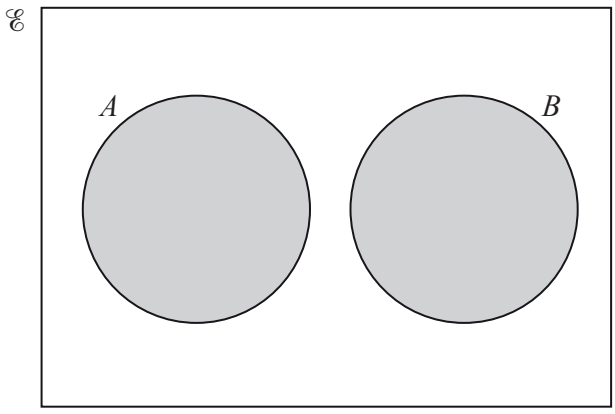

..... [1]

2 The polynomial $\mathrm{p}(x)$ is $ax^3 + bx^2 - 13x + 4$, where a and b are integers. Given that $2x - 1$ is a factor of $\mathrm{p}(x)$ and also a factor of $\mathrm{p}'(x)$,

(i) find the value of a and of b. [5]

View solution

Using your values of a and b,

(ii) find the remainder when $\mathrm{p}(x)$ is divided by $x + 1$. [2]

View solution

3 **(a)** Given that $T = 2\pi l^{\frac{1}{2}} g^{-\frac{1}{2}}$, express l in terms of T, g and π. [2]

View solution

(b) By using the substitution $y = x^{\frac{1}{3}}$, or otherwise, solve $x^{\frac{2}{3}} - 4x^{\frac{1}{3}} + 3 = 0$. [4]

View solution

© UCLES 2017

4 When $\lg y$ is plotted against x^2 a straight line is obtained which passes through the points (4, 3) and (12, 7).

(i) Find the gradient of the line. [1]

View solution

(ii) Use your answer to part **(i)** to express $\lg y$ in terms of x. [2]

View solution

(iii) Hence express y in terms of x, giving your answer in the form $y = A(10^{bx^2})$ where A and b are constants. [3]

View solution

© UCLES 2017

5

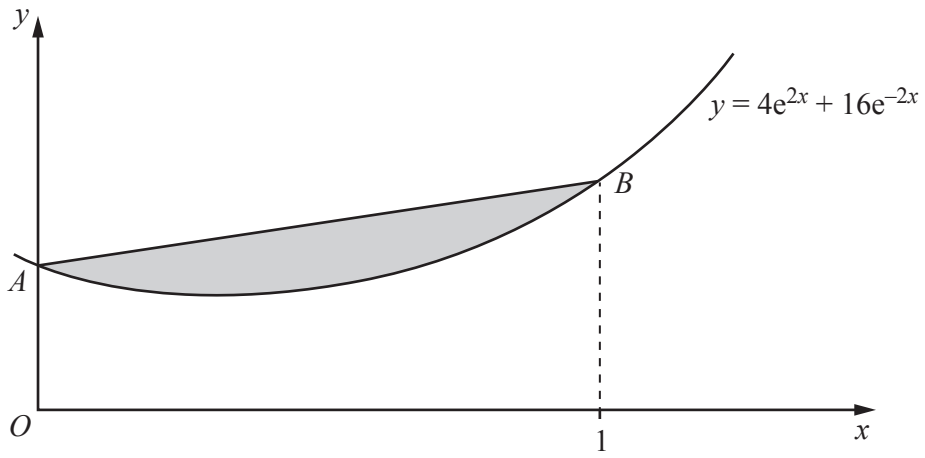

The diagram shows part of the graph of $y = 4e^{2x} + 16e^{-2x}$ meeting the y-axis at the point A and the line $x = 1$ at the point B.

(i) Find the coordinates of A. [1]

View solution

(ii) Find the y-coordinate of B. [1]

View solution

(iii) Find $\int (4e^{2x} + 16e^{-2x})dx$. [2]

View solution

(iv) Hence find the area of the shaded region enclosed by the curve and the line AB. You must show all your working. [4]

View solution

© UCLES 2017

6 **(a)** Functions f and g are such that, for $x \in \mathbb{R}$,

View solution

$$f(x) = x^2 + 3,$$

$$g(x) = 4x - 1.$$

(i) State the range of f. [1]

(ii) Solve $fg(x) = 4$. [3]

View solution

(b) A function h is such that $\mathrm{h}(x) = \dfrac{2x+1}{x-4}$ for $x \in \mathbb{R}$, $x \neq 4$.

(i) Find $\mathrm{h}^{-1}(x)$ and state its range. [4]

View solution

(ii) Find $\mathrm{h}^{2}(x)$, giving your answer in its simplest form. [3]

View solution

7 **(i)** Write $\ln\left(\frac{2x+1}{2x-1}\right)$ as the difference of two logarithms. [1]

View solution

A curve has equation $y = \ln\left(\frac{2x+1}{2x-1}\right) + 4x$ for $x > \frac{1}{2}$.

(ii) Using your answer to part **(i)** show that $\frac{\mathrm{d}y}{\mathrm{d}x} = \frac{ax^2+b}{4x^2-1}$, where a and b are integers. [4]

View solution

© UCLES 2017

(iii) Hence find the x-coordinate of the stationary point on the curve. [2]

View solution

(iv) Determine the nature of this stationary point. [2]

View solution

© UCLES 2017

8 **(a)** 10 people are to be chosen, to receive concert tickets, from a group of 8 men and 6 women.

(i) Find the number of different ways the 10 people can be chosen if 6 of them are men and 4 of them are women. [2]


View solution

The group of 8 men and 6 women contains a man and his wife.

(ii) Find the number of different ways the 10 people can be chosen if both the man and his wife are chosen or neither of them is chosen. [3]


View solution

(b) Freddie has forgotten the 6-digit code that he uses to lock his briefcase. He knows that he did not repeat any digit and that he did not start his code with a zero.

(i) Find the number of different 6-digit numbers he could have chosen. [1]

View solution

Freddie also remembers that his 6-digit code is divisible by 5.

(ii) Find the number of different 6-digit numbers he could have chosen. [3]

View solution

Freddie decides to choose a new 6-digit code for his briefcase once he has opened it. He plans to have the 6-digit number divisible by 2 and greater than 600 000, again with no repetitions of digits.

(iii) Find the number of different 6-digit numbers he can choose. [3]

View solution

© UCLES 2017

9

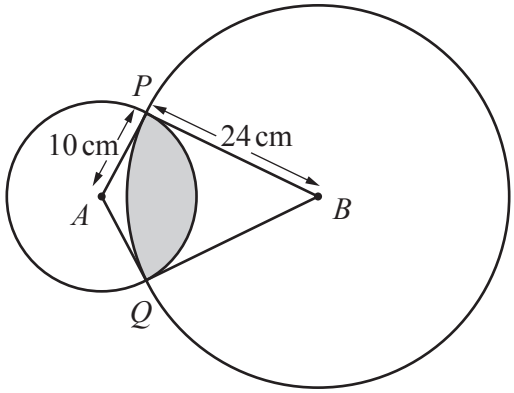

The diagram shows a circle, centre A, radius 10 cm, intersecting a circle, centre B, radius 24 cm. The two circles intersect at the points P and Q. The radii AP and AQ are tangents to the circle with centre B. The radii BP and BQ are tangents to the circle with centre A.

(i) Show that angle PAQ is 2.35 radians, correct to 3 significant figures. [2]

View solution

(ii) Find angle PBQ in radians. [1]

View solution

(iii) Find the perimeter of the shaded region. [3]

View solution

© UCLES 2017

(iv) Find the area of the shaded region. [4]

View solution

Question 10 is printed on the next page.

10 **(a)** Solve $3\operatorname{cosec} 2x - 4\sin 2x = 0$ for $0° \leqslant x \leqslant 180°$. [4]

View solution

(b) Solve $3\tan\left(y - \frac{\pi}{4}\right) = \sqrt{3}$ for $0 \leqslant y \leqslant 2\pi$ radians, giving your answers in terms of π. [4]

View solution

Permission to reproduce items where third-party owned material protected by copyright is included has been sought and cleared where possible. Every reasonable effort has been made by the publisher (UCLES) to trace copyright holders, but if any items requiring clearance have unwittingly been included, the publisher will be pleased to make amends at the earliest possible opportunity.

To avoid the issue of disclosure of answer-related information to candidates, all copyright acknowledgements are reproduced online in the Cambridge International Examinations Copyright Acknowledgements Booklet. This is produced for each series of examinations and is freely available to download at www.cie.org.uk after the live examination series.

Cambridge International Examinations is part of the Cambridge Assessment Group. Cambridge Assessment is the brand name of University of Cambridge Local Examinations Syndicate (UCLES), which is itself a department of the University of Cambridge.

© UCLES 2017