Cambridge IGCSE

Cambridge International Examinations
Cambridge International General Certificate of Secondary Education

CANDIDATE NAME	
CENTRE NUMBER	
CANDIDATE NUMBER	

ADDITIONAL MATHEMATICS **0606/23**

Paper 2 **October/November 2018**

2 hours

Candidates answer on the Question Paper.

Additional Materials: Electronic calculator

READ THESE INSTRUCTIONS FIRST

Write your Centre number, candidate number and name on all the work you hand in.
Write in dark blue or black pen.
You may use an HB pencil for any diagrams or graphs.
Do not use staples, paper clips, glue or correction fluid.
DO **NOT** WRITE IN ANY BARCODES.

Answer **all** the questions.
Give non-exact numerical answers correct to 3 significant figures, or 1 decimal place in the case of angles in degrees, unless a different level of accuracy is specified in the question.
The use of an electronic calculator is expected, where appropriate.
You are reminded of the need for clear presentation in your answers.

At the end of the examination, fasten all your work securely together.
The number of marks is given in brackets [ ] at the end of each question or part question.
The total number of marks for this paper is 80.

This document consists of **15** printed pages and **1** blank page.

© UCLES 2018

Mathematical Formulae

1. ALGEBRA

Quadratic Equation

For the equation $ax^2 + bx + c = 0$,

$$x = \frac{-b \pm \sqrt{b^2 - 4ac}}{2a}.$$

Binomial Theorem

$$(a + b)^n = a^n + \binom{n}{1} a^{n-1} b + \binom{n}{2} a^{n-2} b^2 + \ldots + \binom{n}{r} a^{n-r} b^r + \ldots + b^n,$$

where n is a positive integer and $\binom{n}{r} = \frac{n!}{(n-r)!r!}$.

2. TRIGONOMETRY

Identities

$$\sin^2 A + \cos^2 A = 1$$

$$\sec^2 A = 1 + \tan^2 A$$

$$\operatorname{cosec}^2 A = 1 + \cot^2 A$$

Formulae for ΔABC

$$\frac{a}{\sin A} = \frac{b}{\sin B} = \frac{c}{\sin C}$$

$$a^2 = b^2 + c^2 - 2bc \cos A$$

$$\Delta = \frac{1}{2} bc \sin A$$

© UCLES 2018

1 Solve the equation $|5x-3|=-3x+13$. [3]

View solution

2 On each of the Venn diagrams below, shade the region indicated.

View solution

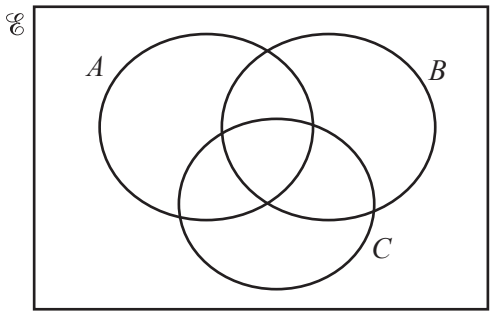

$(A \cup B \cup C)'$

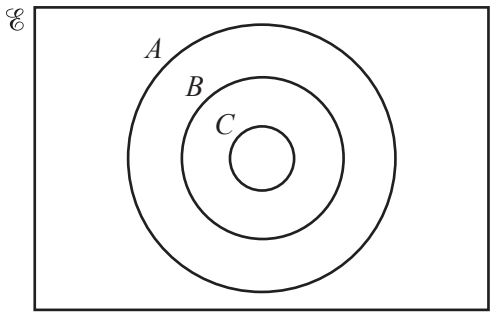

$A \cap B \cap C'$

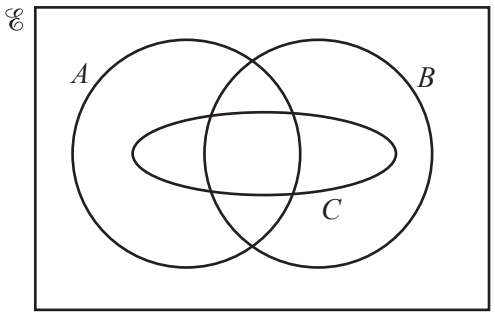

$(A \cap B) \cup C'$

[3]

3 **(i)** Write $8+7x-x^2$ in the form $a-(x-b)^2$, where a and b are constants. [3]

View solution

(ii) Hence state the maximum value of $8+7x-x^2$ and the value of x at which it occurs. [2]

View solution

(iii) Using your answer to **part (i)**, or otherwise, solve the equation $8+7z^2-z^4=0$. [3]

View solution

© UCLES 2018

4 $\dfrac{d^2y}{dx^2} = 2x + \dfrac{3}{(x+1)^4}$

(i) Find $\dfrac{dy}{dx}$, given that $\dfrac{dy}{dx} = 1$ when $x = 1$. [3]

View solution

(ii) Find y in terms of x, given that $y = 3$ when $x = 1$. [3]

View solution

5 Given that $\mathbf{A} = \begin{pmatrix} 2 & 3 \\ 1 & 4 \end{pmatrix}$ and $\mathbf{B} = \begin{pmatrix} 1 & 4 \\ -2 & 5 \end{pmatrix}$, find

(i) $\mathbf{A}^{-1}$, [2]

View solution

(ii) the matrix $\mathbf{C}$ such that $\mathbf{CA} = \mathbf{B}$, [2]

View solution

(iii) the matrix $\mathbf{D}$ such that $\mathbf{A}^{-1}\mathbf{D} + \mathbf{B} = \mathbf{I}$. [3]

View solution

© UCLES 2018

6 Solve the simultaneous equations

View solution

$$\log_2(x+2y) = 3,$$

$$\log_2 3x - \log_2 y = 1.$$

[5]

7 A squad of 20 boys, which includes 2 sets of twins, is available for selection for a cricket team of 11 players. Calculate the number of different teams that can be selected if

(i) there are no restrictions, [1]

View solution

(ii) both sets of twins are selected, [2]

View solution

(iii) one set of twins is selected but neither twin from the other set is selected, [2]

View solution

(iv) exactly one twin from each set of twins is selected. [2]

View solution

8 Variables x and y are such that when y^2 is plotted against e^{2x} a straight line is obtained which passes through the points (1.5, 5.5) and (3.7, 12.1). Find

(i) y in terms of e^{2x}, [3]

View solution

(ii) the value of y when $x = 3$, [1]

View solution

(iii) the value of x when $y = 50$. [3]

View solution

© UCLES 2018

9 **(a)** Solve $2\sin\left(x+\frac{\pi}{4}\right)=\sqrt{3}$ for $0<x<\pi$ radians. [3]

View solution

(b) Solve $3\sec y=4\operatorname{cosec} y$ for $0°<y<360°$. [3]

View solution

(c) Solve $7\cot z - \tan z = 2\operatorname{cosec} z$ for $0° < z < 360°$. [6]

View solution

10 The equation of a curve is $y = x^2\sqrt{3+x}$ for $x \geqslant -3$.

(i) Find $\frac{\mathrm{d}y}{\mathrm{d}x}$. [3]

View solution

(ii) Find the equation of the tangent to the curve $y = x^2\sqrt{3+x}$ at the point where $x = 1$. [3]

View solution

© UCLES 2018

(iii) Find the coordinates of the turning points of the curve $y = x^2\sqrt{3+x}$. [4]

View solution

11 A line with equation $y = -5x + k + 5$ is a tangent to a curve with equation $y = 7 - kx - x^2$.

(i) Find the two possible values of k. [5]

View solution

(ii) Find, for **each** of your values of k,

View solution

- the equation of the tangent
- the equation of the curve
- the coordinates of the point of contact of the tangent and the curve. [5]

© UCLES 2018

(iii) Find the distance between the two points of contact. [2]

View solution

BLANK PAGE

Permission to reproduce items where third-party owned material protected by copyright is included has been sought and cleared where possible. Every reasonable effort has been made by the publisher (UCLES) to trace copyright holders, but if any items requiring clearance have unwittingly been included, the publisher will be pleased to make amends at the earliest possible opportunity.

To avoid the issue of disclosure of answer-related information to candidates, all copyright acknowledgements are reproduced online in the Cambridge International Examinations Copyright Acknowledgements Booklet. This is produced for each series of examinations and is freely available to download at www.cie.org.uk after the live examination series.

Cambridge International Examinations is part of the Cambridge Assessment Group. Cambridge Assessment is the brand name of University of Cambridge Local Examinations Syndicate (UCLES), which is itself a department of the University of Cambridge.