Cambridge IGCSE

Cambridge Assessment International Education
Cambridge International General Certificate of Secondary Education

CANDIDATE NAME									
CENTRE NUMBER						CANDIDATE NUMBER				

ADDITIONAL MATHEMATICS **0606/11**

Paper 1 **October/November 2019**

2 hours

Candidates answer on the Question Paper.

Additional Materials: Electronic calculator

READ THESE INSTRUCTIONS FIRST

Write your centre number, candidate number and name on all the work you hand in.
Write in dark blue or black pen.
You may use an HB pencil for any diagrams or graphs.
Do not use staples, paper clips, glue or correction fluid.
DO **NOT** WRITE IN ANY BARCODES.

Answer **all** the questions.
Give non-exact numerical answers correct to 3 significant figures, or 1 decimal place in the case of angles in degrees, unless a different level of accuracy is specified in the question.
The use of an electronic calculator is expected, where appropriate.
You are reminded of the need for clear presentation in your answers.

At the end of the examination, fasten all your work securely together.
The number of marks is given in brackets [ ] at the end of each question or part question.
The total number of marks for this paper is 80.

© UCLES 2019

Cambridge Assessment International Education

Mathematical Formulae

1. ALGEBRA

Quadratic Equation

For the equation $ax^2 + bx + c = 0$,

$$x = \frac{-b \pm \sqrt{b^2 - 4ac}}{2a}.$$

Binomial Theorem

$$(a + b)^n = a^n + \binom{n}{1} a^{n-1} b + \binom{n}{2} a^{n-2} b^2 + \ldots + \binom{n}{r} a^{n-r} b^r + \ldots + b^n,$$

where n is a positive integer and $\binom{n}{r} = \frac{n!}{(n-r)!r!}$.

2. TRIGONOMETRY

Identities

$$\sin^2 A + \cos^2 A = 1$$

$$\sec^2 A = 1 + \tan^2 A$$

$$\operatorname{cosec}^2 A = 1 + \cot^2 A$$

Formulae for ΔABC

$$\frac{a}{\sin A} = \frac{b}{\sin B} = \frac{c}{\sin C}$$

$$a^2 = b^2 + c^2 - 2bc \cos A$$

$$\Delta = \frac{1}{2} bc \sin A$$

© UCLES 2019

1 Using set notation, describe the regions shaded on the Venn diagrams below.

View solution

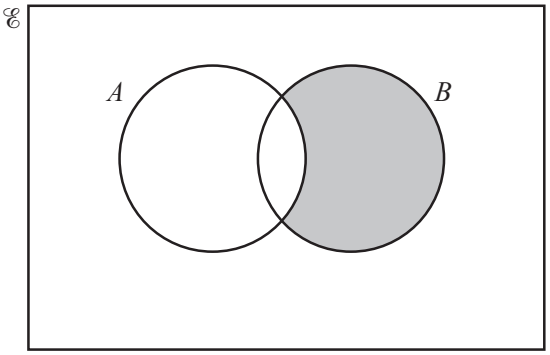

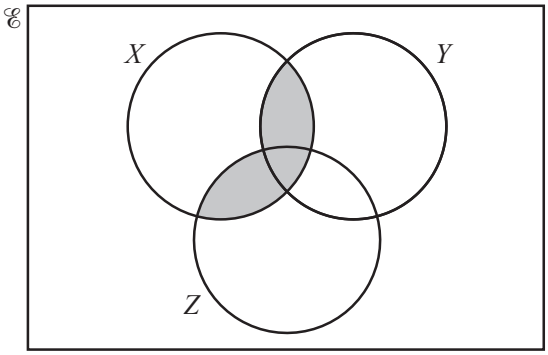

.... [2]

2 Find the values of k for which the line $y = kx - 3$ and the curve $y = 2x^2 + 3x + k$ do not intersect. [5]

View solution

© UCLES 2019

3 Given that $7^x \times 49^y = 1$ and $5^{5x} \times 125^{\frac{2y}{3}} = \frac{1}{25}$, calculate the value of x and of y. [5]

View solution

4 It is given that $y = \dfrac{\ln(4x^2 + 1)}{2x - 3}$.

(i) Find $\dfrac{\mathrm{d}y}{\mathrm{d}x}$. [3]

View solution

(ii) Find the approximate change in y as x increases from 2 to $2 + h$, where h is small. [2]

View solution

© UCLES 2019

5 $\mathrm{f}(x) = 3\mathrm{e}^{2x} + 1 \quad$ for $x \in \mathbb{R}$

$\mathrm{g}(x) = x + 1 \quad$ for $x \in \mathbb{R}$

(i) Write down the range of f and of g. [2]

View solution

(ii) Evaluate $\mathrm{fg}^2(0)$. [2]

View solution

(iii) On the axes below, sketch the graphs of $y = \mathrm{f}(x)$ and $y = \mathrm{f}^{-1}(x)$, stating the coordinates of the points where the graphs meet the coordinate axes. [3]

View solution

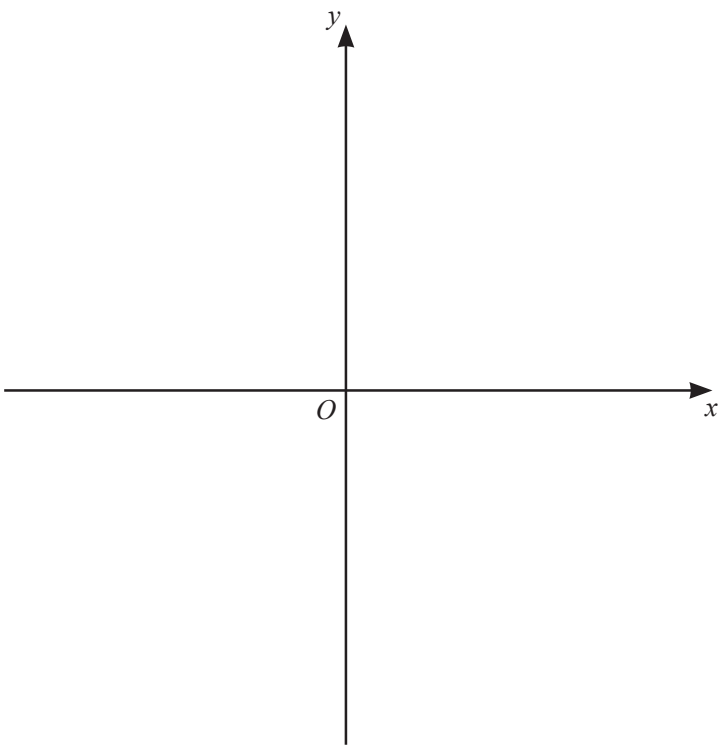

© UCLES 2019

6 Find the equation of the normal to the curve $y = \sqrt{8x+5}$ at the point where $x = \frac{1}{2}$, giving your answer in the form $ax + by + c = 0$, where a, b and c are integers. [5]

View solution

© UCLES 2019

7 When lg y is plotted against x, a straight line graph passing through the points (2.2, 3.6) and (3.4, 6) is obtained.

(i) Given that $y = Ab^x$, find the value of each of the constants A and b. [5]

View solution

(ii) Find x when $y = 900$. [2]

View solution

8 Do not use a calculator in this question.

In this question, all lengths are in centimetres.

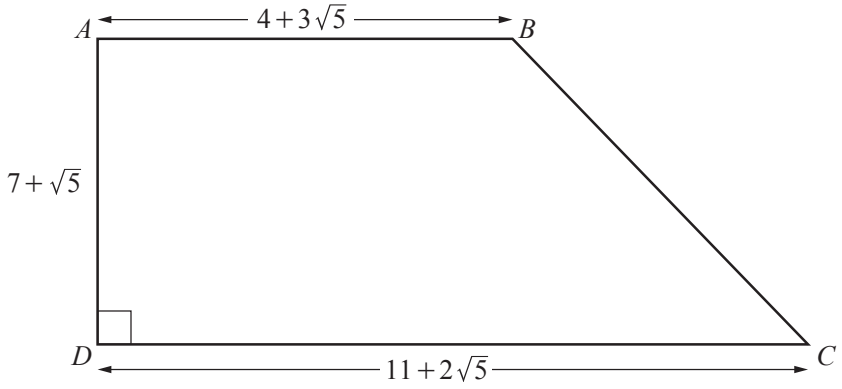

The diagram shows the trapezium $ABCD$ in which angle ADC is 90° and AB is parallel to DC. It is given that $AB = 4 + 3\sqrt{5}$, $DC = 11 + 2\sqrt{5}$ and $AD = 7 + \sqrt{5}$.

(i) Find the perimeter of the trapezium, giving your answer in simplest surd form. [3]

View solution

(ii) Find the area of the trapezium, giving your answer in simplest surd form. [3]

View solution

© UCLES 2019

9

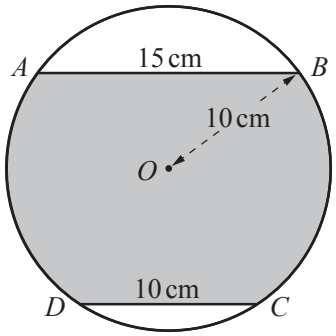

The diagram shows a circle with centre O and radius 10 cm. The points A, B, C and D lie on the circle such that the chord $AB = 15$ cm and the chord $CD = 10$ cm. The chord AB is parallel to the chord DC.

(i) Show that the angle AOB is 1.70 radians correct to 2 decimal places. [2]

View solution

(ii) Find the perimeter of the shaded region. [4]

View solution

(iii) Find the area of the shaded region. [4]

View solution

© UCLES 2019

10

View solution

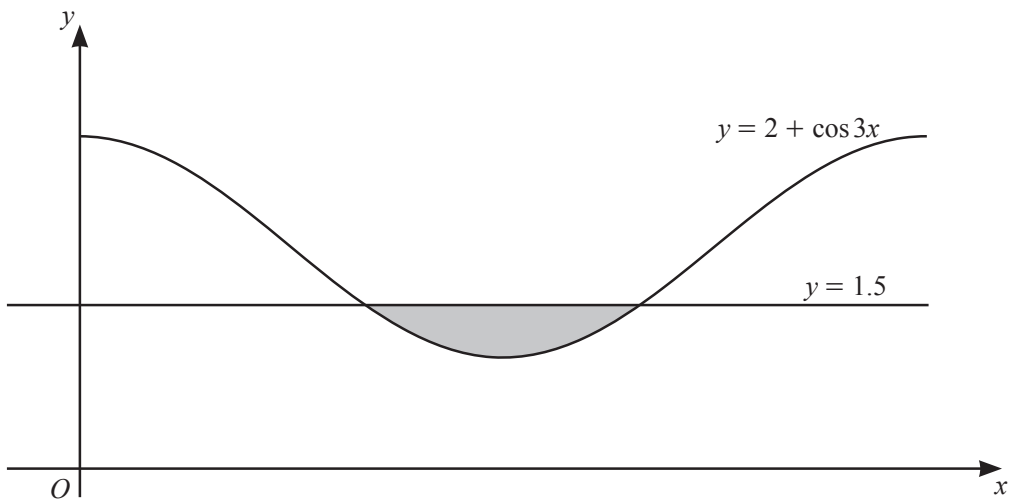

The diagram shows part of the graph of $y = 2 + \cos 3x$ and the straight line $y = 1.5$. Find the exact area of the shaded region bounded by the curve and the straight line. You must show all your working. [9]

© UCLES 2019

Continuation of working space for Question 10

11 **(a)** Jess wants to arrange 9 different books on a shelf. There are 4 mathematics books, 3 physics books and 2 chemistry books. Find the number of different possible arrangements of the books if

View solution

(i) there are no restrictions, [1]

(ii) a chemistry book is at each end of the shelf, [2]

View solution

(iii) all the mathematics books are kept together and all the physics books are kept together. [3]

View solution

© UCLES 2019

(b) A quiz team of 6 children is to be chosen from a class of 8 boys and 10 girls. Find the number of ways of choosing the team if

View solution

(i) there are no restrictions, [1]

(ii) there are more boys than girls in the team. [4]

View solution

Question 12 is printed on the next page.

© UCLES 2019

12 A curve is such that $\frac{d^2y}{dx^2} = 2\sin\left(x + \frac{\pi}{3}\right)$. Given that the curve has a gradient of 5 at the point $\left(\frac{\pi}{3}, \frac{5\pi}{3}\right)$, find the equation of the curve. [8]

View solution

Permission to reproduce items where third-party owned material protected by copyright is included has been sought and cleared where possible. Every reasonable effort has been made by the publisher (UCLES) to trace copyright holders, but if any items requiring clearance have unwittingly been included, the publisher will be pleased to make amends at the earliest possible opportunity.

To avoid the issue of disclosure of answer-related information to candidates, all copyright acknowledgements are reproduced online in the Cambridge Assessment International Education Copyright Acknowledgements Booklet. This is produced for each series of examinations and is freely available to download at www.cambridgeinternational.org after the live examination series.

Cambridge Assessment International Education is part of the Cambridge Assessment Group. Cambridge Assessment is the brand name of the University of Cambridge Local Examinations Syndicate (UCLES), which itself is a department of the University of Cambridge.

© UCLES 2019