Cambridge IGCSE

Cambridge Assessment International Education
Cambridge International General Certificate of Secondary Education

CANDIDATE NAME									
CENTRE NUMBER						CANDIDATE NUMBER				

ADDITIONAL MATHEMATICS **0606/13**

Paper 1 **October/November 2019**

2 hours

Candidates answer on the Question Paper.

Additional Materials: Electronic calculator

READ THESE INSTRUCTIONS FIRST

Write your centre number, candidate number and name on all the work you hand in.
Write in dark blue or black pen.
You may use an HB pencil for any diagrams or graphs.
Do not use staples, paper clips, glue or correction fluid.
DO **NOT** WRITE IN ANY BARCODES.

Answer **all** the questions.
Give non-exact numerical answers correct to 3 significant figures, or 1 decimal place in the case of angles in degrees, unless a different level of accuracy is specified in the question.
The use of an electronic calculator is expected, where appropriate.
You are reminded of the need for clear presentation in your answers.

At the end of the examination, fasten all your work securely together.
The number of marks is given in brackets [ ] at the end of each question or part question.
The total number of marks for this paper is 80.

This document consists of **15** printed pages and **1** blank page.

© UCLES 2019

Mathematical Formulae

1. ALGEBRA

Quadratic Equation

For the equation $ax^2 + bx + c = 0$,

$$x = \frac{-b \pm \sqrt{b^2 - 4ac}}{2a}.$$

Binomial Theorem

$$(a + b)^n = a^n + \binom{n}{1} a^{n-1} b + \binom{n}{2} a^{n-2} b^2 + \ldots + \binom{n}{r} a^{n-r} b^r + \ldots + b^n,$$

where n is a positive integer and $\binom{n}{r} = \frac{n!}{(n-r)!r!}$.

2. TRIGONOMETRY

Identities

$$\sin^2 A + \cos^2 A = 1$$
$$\sec^2 A = 1 + \tan^2 A$$
$$\operatorname{cosec}^2 A = 1 + \cot^2 A$$

Formulae for ΔABC

$$\frac{a}{\sin A} = \frac{b}{\sin B} = \frac{c}{\sin C}$$

$$a^2 = b^2 + c^2 - 2bc \cos A$$

$$\Delta = \frac{1}{2} bc \sin A$$

© UCLES 2019

1 In a group of 145 students, the numbers studying mathematics, physics and chemistry are given below. All students study at least one of the three subjects.

x students study all 3 subjects

24 students study both mathematics and chemistry

23 students study both physics and chemistry

28 students study both mathematics and physics

50 students study chemistry

75 students study physics

80 students study mathematics

(i) Using the Venn diagram, find the value of x. [4]

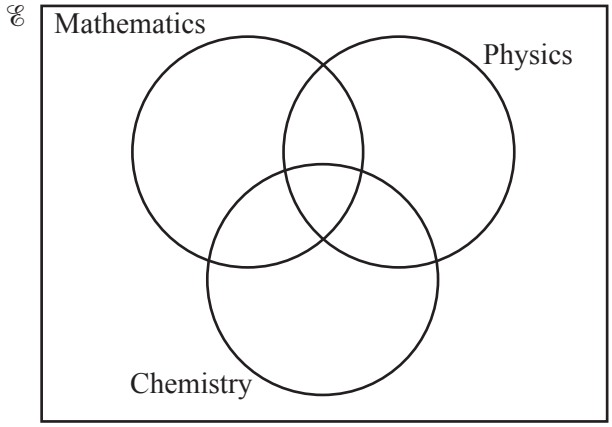

View solution

(ii) Find the number of students who study mathematics only. [1]

View solution

© UCLES 2019

2 **(i)** On the axes below, sketch the graph of $y = 5\cos 4x - 3$ for $-90° \leqslant x \leqslant 90°$.

View solution

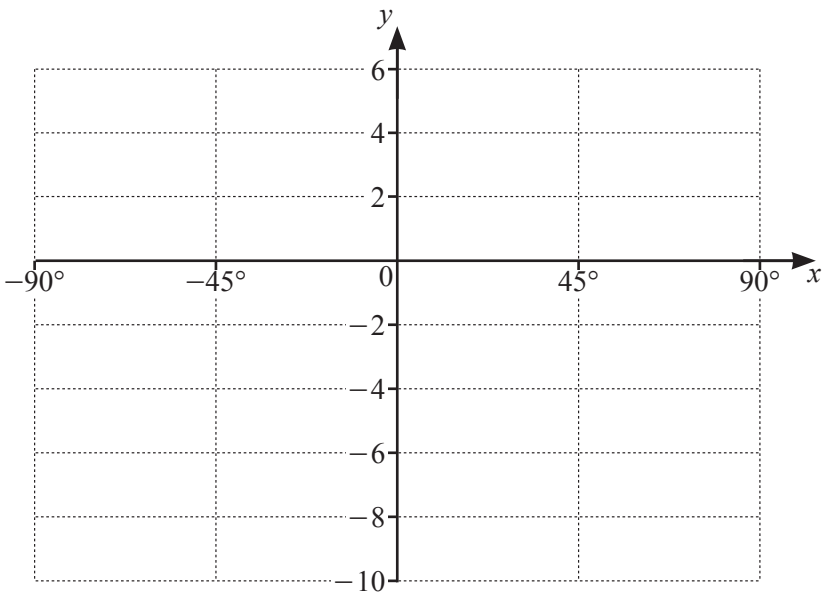

[4]

(ii) Write down the amplitude of y. [1]

View solution

(iii) Write down the period of y. [1]

View solution

3 **(i)** Differentiate $y = \left(3x^2 - 1\right)^{-\frac{1}{3}}$ with respect to x. [2]

View solution

(ii) Find the approximate change in y as x increases from $\sqrt{3}$ to $\sqrt{3} + p$, where p is small. [1]

View solution

(iii) Find the equation of the normal to the curve $y = \left(3x^2 - 1\right)^{-\frac{1}{3}}$ at the point where $x = \sqrt{3}$. [3]

View solution

© UCLES 2019

4 It is given that $\mathbf{A} = \begin{pmatrix} 5 & 2 \\ 4 & -1 \end{pmatrix}$.

(i) Find $\mathbf{A}^{-1}$. [2]

View solution

(ii) Hence find, in radians, the acute angles x and y such that

View solution

$$5\tan x + 2\tan y = 12,$$
$$4\tan x - \tan y = 7.$$

[5]

5 **(i)** Differentiate $(x^2+3)\ln(x^2+3)$ with respect to x. [3]

View solution

(ii) Hence find $\int x\ln(x^2+3)\,\mathrm{d}x$. [2]

View solution

6

x	1	1.5	2	2.5	3
y	6	14.3	48	228	1536

The table shows values of the variables x and y such that $y = Ab^{x^2}$, where A and b are constants.

(i) Draw a straight line graph to show that $y = Ab^{x^2}$. [4]

View solution



(ii) Use your graph to find the value of A and of b. [4]

View solution

(iii) Estimate the value of x when $y = 100$. [2]

View solution

7 **(a)** A 5-digit code is to be chosen from the digits 1, 2, 3, 4, 5, 6, 7, 8 and 9. Each digit may be used once only in any 5-digit code. Find the number of different 5-digit codes that may be chosen if

(i) there are no restrictions, [1]

View solution

(ii) the code is divisible by 5, [1]

View solution

(iii) the code is even and greater than 70 000. [3]

View solution

(b) A team of 6 people is to be chosen from 8 men and 6 women. Find the number of different teams that may be chosen if

(i) there are no restrictions, [1]

View solution

(ii) there are no women in the team, [1]

View solution

(iii) there are a husband and wife who must not be separated. [3]

View solution

© UCLES 2019

8 **(a)** Given that $\log_a x = p$ and $\log_a y = q$, find, in terms of p and q,

(i) $\log_a axy^2$, [2]

View solution

(ii) $\log_a\left(\frac{x^3}{ay}\right)$, [2]

View solution

(iii) $\log_x a + \log_y a$. [1]

View solution

(b) Using the substitution $m = 3^x$, or otherwise, solve $3^x - 3^{1+2x} + 4 = 0$. [3]

View solution

© UCLES 2019

9

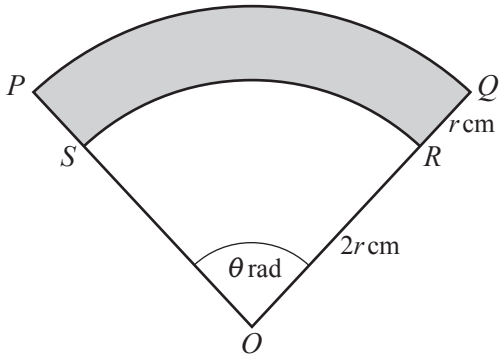

The diagram shows a sector OPQ of the circle centre O, radius $3r$ cm. The points S and R lie on OP and OQ respectively such that ORS is a sector of the circle centre O, radius $2r$ cm. The angle $POQ = \theta$ radians. The perimeter of the shaded region $PQRS$ is 100 cm.

(i) Find θ in terms of r. [2]

View solution

(ii) Hence show that the area, A cm^2, of the shaded region $PQRS$ is given by $A = 50r - r^2$. [2]

View solution

(iii) Given that r can vary and that A has a maximum value, find this value of A. [2]

View solution

(iv) Given that A is increasing at the rate of $3\,\text{cm}^2\,\text{s}^{-1}$ when $r = 10$, find the corresponding rate of change of r. [3]

View solution

(v) Find the corresponding rate of change of θ when $r = 10$. [3]

View solution

10 (a)

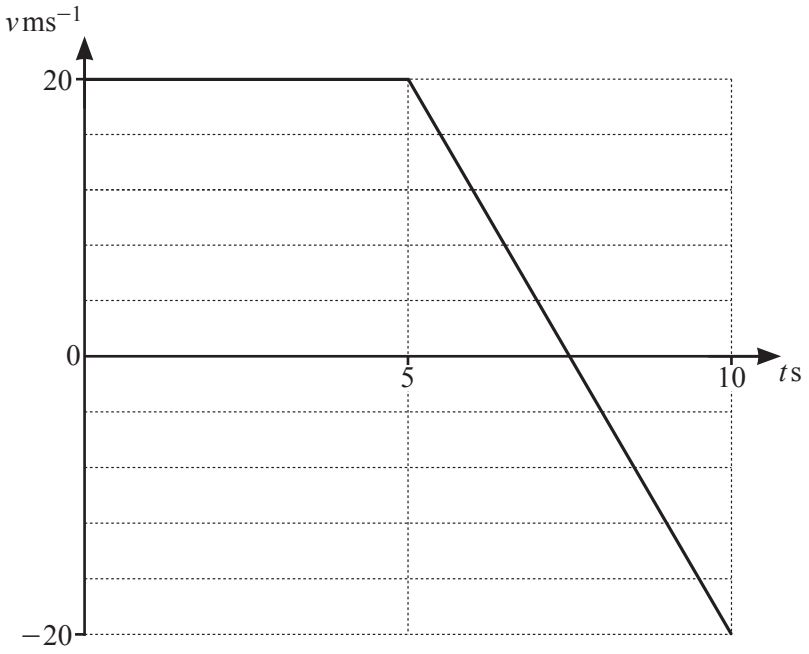

The velocity-time graph for a particle P is shown by the two straight lines in the diagram.

(i) Find the deceleration of P for $5 \leqslant t \leqslant 10$. [2]

(ii) Write down the value of t when the speed of P is zero. [1]

(iii) Find the distance P has travelled for $0 \leqslant t \leqslant 10$. [2]

© UCLES 2019

(b) A particle Q has a displacement of x m from a fixed point O, t s after leaving O. The velocity, $v\,\text{ms}^{-1}$, of Q at time t s is given by $v = 6e^{2t} + 1$.

(i) Find an expression for x in terms of t. [3]

View solution

(ii) Find the value of t when the acceleration of Q is $24\,\text{ms}^{-2}$. [3]

View solution

BLANK PAGE

Permission to reproduce items where third-party owned material protected by copyright is included has been sought and cleared where possible. Every reasonable effort has been made by the publisher (UCLES) to trace copyright holders, but if any items requiring clearance have unwittingly been included, the publisher will be pleased to make amends at the earliest possible opportunity.

To avoid the issue of disclosure of answer-related information to candidates, all copyright acknowledgements are reproduced online in the Cambridge Assessment International Education Copyright Acknowledgements Booklet. This is produced for each series of examinations and is freely available to download at www.cambridgeinternational.org after the live examination series.

Cambridge Assessment International Education is part of the Cambridge Assessment Group. Cambridge Assessment is the brand name of the University of Cambridge Local Examinations Syndicate (UCLES), which itself is a department of the University of Cambridge.

© UCLES 2019