Cambridge Assessment International Education

Cambridge IGCSE™

CANDIDATE NAME									
CENTRE NUMBER						CANDIDATE NUMBER				

ADDITIONAL MATHEMATICS **0606/11**

Paper 1 **October/November 2021**

2 hours

You must answer on the question paper.

No additional materials are needed.

INSTRUCTIONS

- Answer **all** questions.
- Use a black or dark blue pen. You may use an HB pencil for any diagrams or graphs.
- Write your name, centre number and candidate number in the boxes at the top of the page.
- Write your answer to each question in the space provided.
- Do **not** use an erasable pen or correction fluid.
- Do **not** write on any bar codes.
- You should use a calculator where appropriate.
- You must show all necessary working clearly; no marks will be given for unsupported answers from a calculator.
- Give non-exact numerical answers correct to 3 significant figures, or 1 decimal place for angles in degrees, unless a different level of accuracy is specified in the question.

INFORMATION

- The total mark for this paper is 80.
- The number of marks for each question or part question is shown in brackets [ ].

© UCLES 2021

Mathematical Formulae

1. ALGEBRA

Quadratic Equation

For the equation $ax^2 + bx + c = 0$,

$$x = \frac{-b \pm \sqrt{b^2 - 4ac}}{2a}$$

Binomial Theorem

$$(a+b)^n = a^n + \binom{n}{1}a^{n-1}b + \binom{n}{2}a^{n-2}b^2 + \ldots + \binom{n}{r}a^{n-r}b^r + \ldots + b^n$$

where n is a positive integer and $\binom{n}{r} = \frac{n!}{(n-r)!r!}$

Arithmetic series

$$u_n = a + (n-1)d$$

$$S_n = \frac{1}{2}n(a+l) = \frac{1}{2}n\{2a + (n-1)d\}$$

Geometric series

$$u_n = ar^{n-1}$$

$$S_n = \frac{a(1-r^n)}{1-r} \quad (r \neq 1)$$

$$S_\infty = \frac{a}{1-r} \quad (|r| < 1)$$

2. TRIGONOMETRY

Identities

$$\sin^2 A + \cos^2 A = 1$$
$$\sec^2 A = 1 + \tan^2 A$$
$$\operatorname{cosec}^2 A = 1 + \cot^2 A$$

Formulae for ΔABC

$$\frac{a}{\sin A} = \frac{b}{\sin B} = \frac{c}{\sin C}$$

$$a^2 = b^2 + c^2 - 2bc\cos A$$

$$\Delta = \frac{1}{2}bc\sin A$$

© UCLES 2021

1

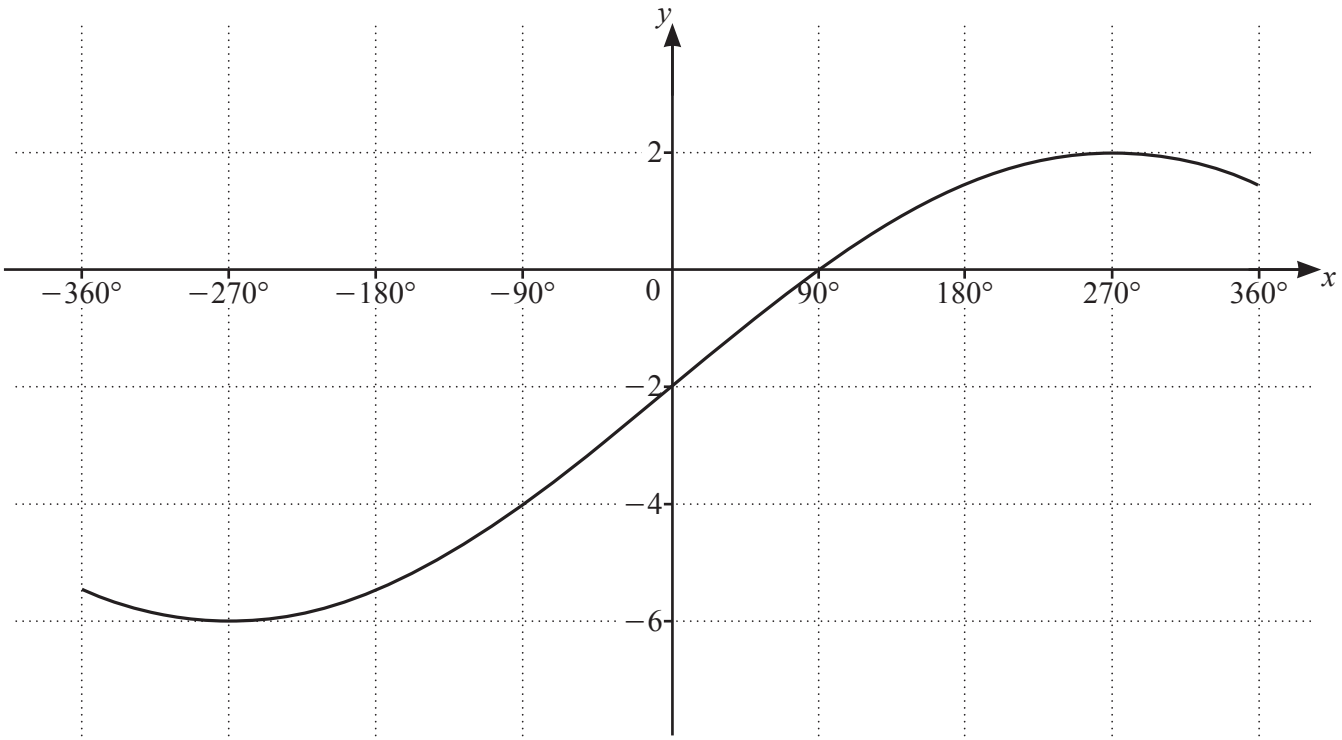

The diagram shows the graph of $y = a\sin\frac{x}{b} + c$ for $-360° \leqslant x \leqslant 360°$, where a, b and c are integers.

(a) Write down the period of $a\sin\frac{x}{b} + c$. [1]

View solution

(b) Find the value of a, of b and of c. [3]

View solution

2 Points A and C have coordinates $(-4, 6)$ and $(2, 18)$ respectively. The point B lies on the line AC such that $\overrightarrow{AB} = \frac{2}{3}\overrightarrow{AC}$.

(a) Find the coordinates of B. [2]

View solution

(b) Find the equation of the line l, which is perpendicular to AC and passes through B. [2]

View solution

(c) Find the area enclosed by the line l and the coordinate axes. [2]

View solution

© UCLES 2021

3 **(a)** Find the vector which has magnitude 39 and is in the same direction as $\begin{pmatrix} 12 \\ -5 \end{pmatrix}$. [2]

View solution

(b) Given that $\mathbf{a} = \begin{pmatrix} 2 \\ -1 \end{pmatrix}$ and $\mathbf{b} = \begin{pmatrix} -4 \\ 5 \end{pmatrix}$, find the constants λ and μ such that $5\mathbf{a} + \lambda\begin{pmatrix} 4 \\ 6 \end{pmatrix} = \mu\mathbf{b}$. [4]

View solution

© UCLES 2021

4 **(a)** Given that $\dfrac{q^{-2}\sqrt{pr}}{\sqrt[3]{r}(pq)^{-3}} = p^a q^b r^c$, find the value of each of the constants a, b and c. [3]

View solution

(b) Solve the equation $3x^{\frac{4}{5}} - 8x^{\frac{2}{5}} + 5 = 0$. [4]

View solution

5 The polynomial $\mathrm{p}(x) = ax^3 + bx^2 + 6x + 4$, where a and b are integers, is divisible by $x - 2$. When $\mathrm{p}'(x)$ is divided by $x + 1$ the remainder is -7.

(a) Find the value of a and of b. [5]

View solution

(b) Using your answers to **part (a)**, find the remainder when $\mathrm{p}''(x)$ is divided by x. [2]

View solution

© UCLES 2021

6 A curve with equation $y = \mathrm{f}(x)$ is such that $\dfrac{\mathrm{d}^2y}{\mathrm{d}x^2} = 6\mathrm{e}^{3x} + 4x$. The curve has a gradient of 5 at the point $\left(0, \dfrac{5}{3}\right)$. Find $\mathrm{f}(x)$. [7]

View solution

7 The first three terms, in ascending powers of x, in the expansion of $(2+ax)^n$ can be written as $64+bx+cx^2$, where n, a, b and c are constants.

(a) Find the value of n. [1]

View solution

(b) Show that $5b^2 = 768c$. [4]

View solution

(c) Given that $b = 12$, find the exact value of a and of c. [2]

View solution

8

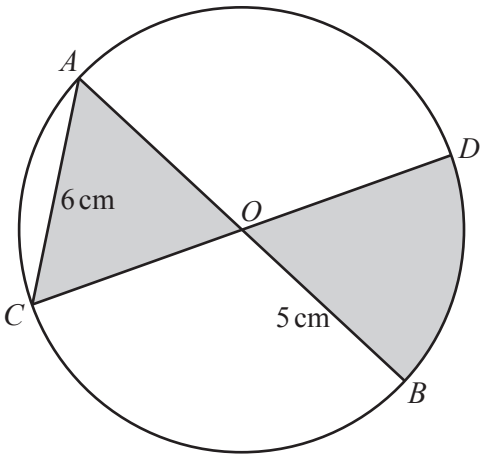

The diagram shows a circle, centre O, radius 5 cm. The lines AOB and COD are diameters of this circle. The line AC has length 6 cm.

(a) Show that angle $AOC = 1.287$ radians, correct to 3 decimal places. [2]

View solution

(b) Find the perimeter of the shaded region. [2]

View solution

(c) Find the area of the shaded region. [3]

View solution

9 **(a)** Find the coordinates of the stationary points on the curve $y = (2x+1)(x-3)^2$. Give your answers in exact form. [4]

View solution

(b) On the axes below, sketch the graph of $y = \left|(2x+1)(x-3)^2\right|$, stating the coordinates of the points where the curve meets the axes. [4]

View solution

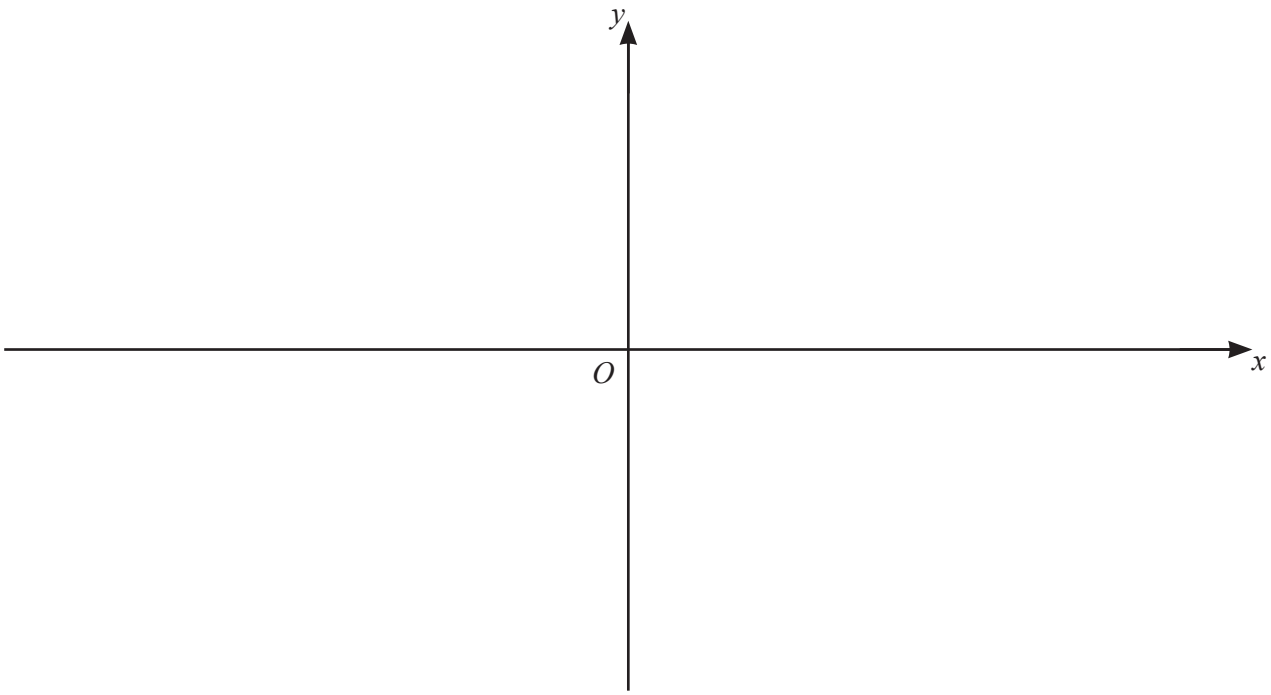

(c) Hence write down the value of the constant k such that $\left|(2x+1)(x-3)^2\right| = k$ has exactly 3 distinct solutions. [1]

View solution

10 **(a)** Jess runs on 5 days each week to prepare for a race.
In week 1, every run is 2 km.
In week 2, every run is 2.5 km.
In week 3, every run is 3 km.
Jess increases the distance of the run by 0.5 km every week.

View solution

(i) Find the week in which Jess runs 16 km on each of the 5 days. [2]

(ii) Find the total distance Jess will have run by the end of week 8. [3]

View solution

(b) Kyle also runs on 5 days each week to prepare for a race.
In week 1, every run is 2 km.
In week 2, every run is 2.5 km.
In week 3, every run is 3.125 km.
The distances he runs each week form a geometric progression.

View solution

(i) Find the common ratio of the geometric progression. [1]

(ii) Find the first week in which Kyle will run more than 16 km on each of the 5 days. [3]

View solution

(iii) Find the total distance Kyle will have run by the end of week 8. [3]

View solution

Question 11 is printed on the next page.

© UCLES 2021

11 **(a)** Solve the equation $3\,\text{cosec}^2\theta - 5 = 5\cot\theta$ for $0° \leqslant \theta \leqslant 180°$. [4]

View solution

(b) Solve the equation $\sin\left(\phi + \frac{\pi}{3}\right) = -\frac{1}{2}$, where ϕ is in radians and $-\pi \leqslant \phi \leqslant \pi$. Give your answers in terms of π. [4]

View solution

Permission to reproduce items where third-party owned material protected by copyright is included has been sought and cleared where possible. Every reasonable effort has been made by the publisher (UCLES) to trace copyright holders, but if any items requiring clearance have unwittingly been included, the publisher will be pleased to make amends at the earliest possible opportunity.

To avoid the issue of disclosure of answer-related information to candidates, all copyright acknowledgements are reproduced online in the Cambridge Assessment International Education Copyright Acknowledgements Booklet. This is produced for each series of examinations and is freely available to download at www.cambridgeinternational.org after the live examination series.

Cambridge Assessment International Education is part of the Cambridge Assessment Group. Cambridge Assessment is the brand name of the University of Cambridge Local Examinations Syndicate (UCLES), which itself is a department of the University of Cambridge.

© UCLES 2021