Cambridge Assessment International Education

Cambridge IGCSE™

CANDIDATE NAME									
CENTRE NUMBER						CANDIDATE NUMBER				

ADDITIONAL MATHEMATICS **0606/13**

Paper 1 **October/November 2022**

2 hours

You must answer on the question paper.

No additional materials are needed.

INSTRUCTIONS

- Answer **all** questions.
- Use a black or dark blue pen. You may use an HB pencil for any diagrams or graphs.
- Write your name, centre number and candidate number in the boxes at the top of the page.
- Write your answer to each question in the space provided.
- Do **not** use an erasable pen or correction fluid.
- Do **not** write on any bar codes.
- You should use a calculator where appropriate.
- You must show all necessary working clearly; no marks will be given for unsupported answers from a calculator.
- Give non-exact numerical answers correct to 3 significant figures, or 1 decimal place for angles in degrees, unless a different level of accuracy is specified in the question.

INFORMATION

- The total mark for this paper is 80.
- The number of marks for each question or part question is shown in brackets [ ].

© UCLES 2022

Mathematical Formulae

1. ALGEBRA

Quadratic Equation

For the equation $ax^2 + bx + c = 0$,

$$x = \frac{-b \pm \sqrt{b^2 - 4ac}}{2a}$$

Binomial Theorem

$$(a+b)^n = a^n + \binom{n}{1}a^{n-1}b + \binom{n}{2}a^{n-2}b^2 + \ldots + \binom{n}{r}a^{n-r}b^r + \ldots + b^n$$

where n is a positive integer and $\binom{n}{r} = \frac{n!}{(n-r)!r!}$

Arithmetic series $u_n = a + (n-1)d$

$$S_n = \frac{1}{2}n(a+l) = \frac{1}{2}n\{2a + (n-1)d\}$$

Geometric series $u_n = ar^{n-1}$

$$S_n = \frac{a(1-r^n)}{1-r} \quad (r \neq 1)$$

$$S_\infty = \frac{a}{1-r} \quad (|r| < 1)$$

2. TRIGONOMETRY

Identities

$$\sin^2 A + \cos^2 A = 1$$
$$\sec^2 A = 1 + \tan^2 A$$
$$\operatorname{cosec}^2 A = 1 + \cot^2 A$$

Formulae for ΔABC

$$\frac{a}{\sin A} = \frac{b}{\sin B} = \frac{c}{\sin C}$$

$$a^2 = b^2 + c^2 - 2bc\cos A$$

$$\Delta = \frac{1}{2}bc\sin A$$

© UCLES 2022

1 On the axes, sketch the graph of $y = 4\sin 3x - 2$ for $-\frac{\pi}{3} \leqslant x \leqslant \frac{\pi}{3}$. [3]

View solution

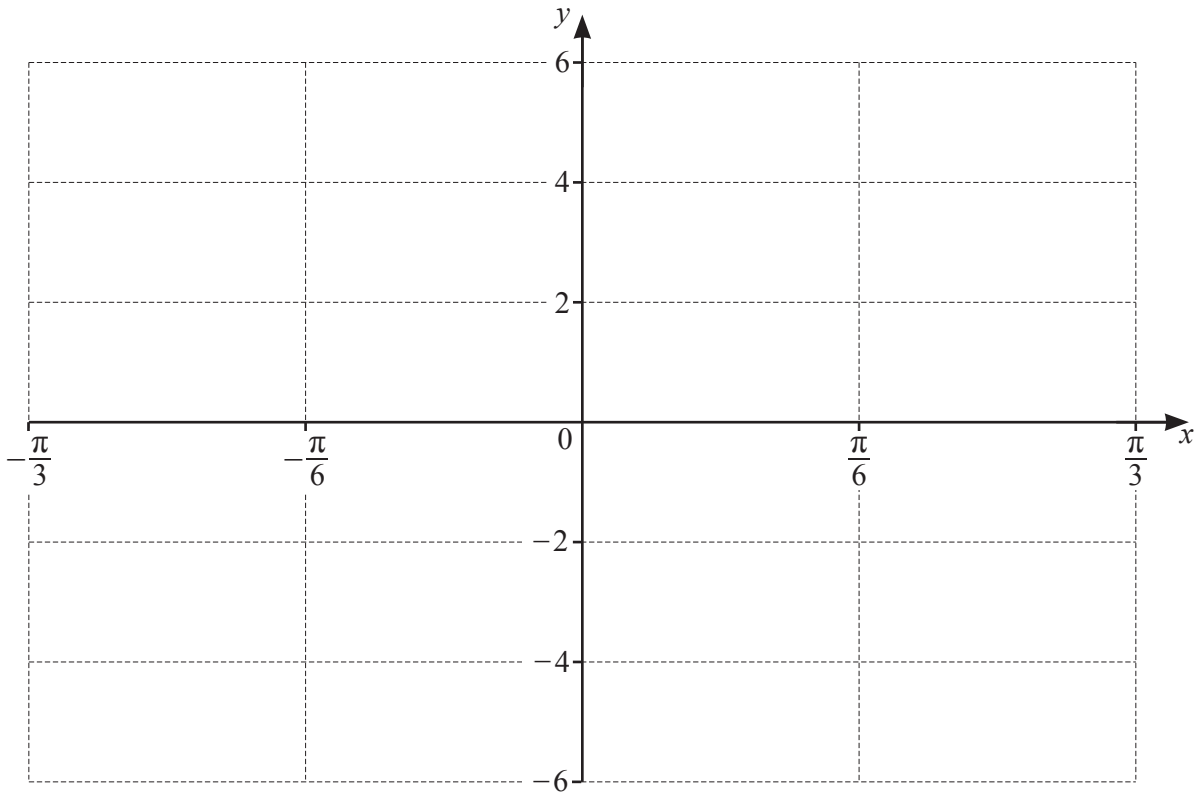

2 **(a)** Show that $2x^2 + x - 15$ can be written in the form $2(x+a)^2 + b$, where a and b are exact constants to be found. [2]

View solution

(b) Hence write down the coordinates of the stationary point on the curve $y = 2x^2 + x - 15$. [2]

View solution

(c) On the axes, sketch the graph of $y = |2x^2 + x - 15|$, stating the coordinates of the points where the graph meets the coordinate axes. [3]

View solution

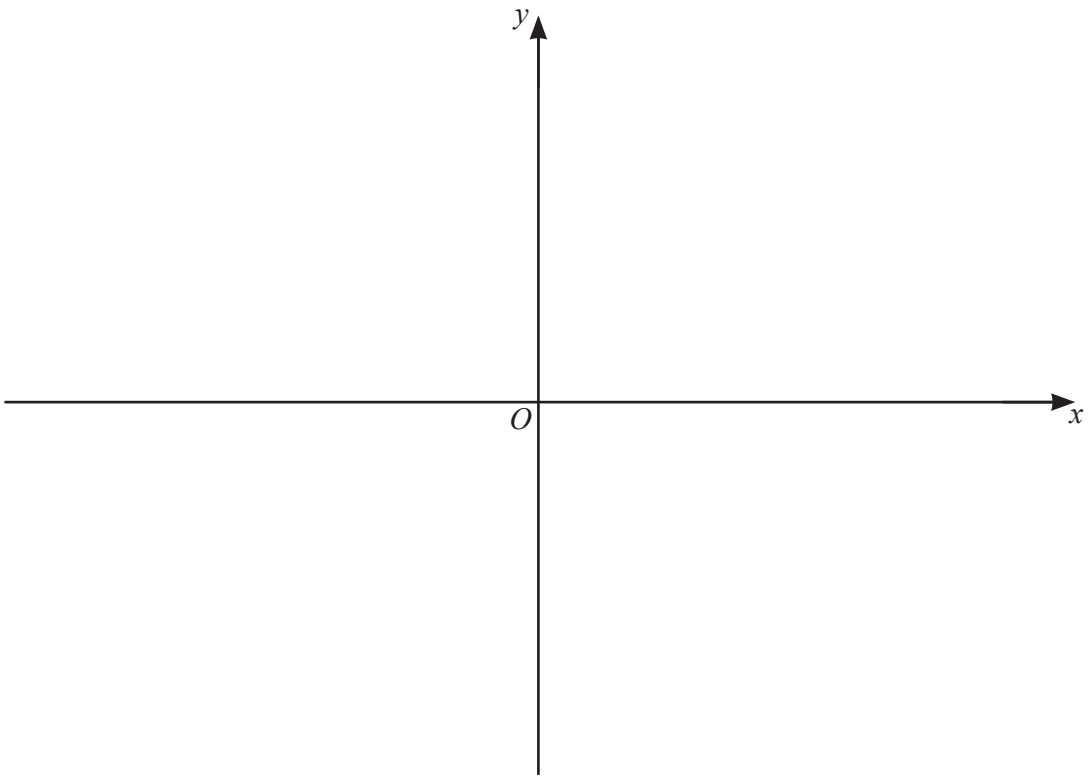

(d) Write down the value of the constant k for which the equation $|2x^2 + x - 15| = k$ has 3 distinct solutions. [1]

View solution

3 **(a)** Solve the following simultaneous equations.

View solution

$$3y - 2x + 2 = 0$$

$$xy = \frac{1}{2}$$

[3]

(b) Solve the equation $\log_3 x + 3 = 10 \log_x 3$, giving your answers as powers of 3. [4]

View solution

© UCLES 2022

4 The polynomial $\mathrm{p}(x)$ is such that $\mathrm{p}(x) = ax^3 + 13x^2 + bx + c$, where a, b and c are integers. It is given that $\mathrm{p}'(0) = -9$.

(a) Show that $b = -9$. [1]

View solution

It is also given that $3x + 2$ is a factor of $\mathrm{p}(x)$ and that when $\mathrm{p}(x)$ is divided by $x + 1$ the remainder is 6.

(b) Find the values of a and c. [4]

View solution

(c) Find the quadratic $\mathrm{q}(x)$ such that $\mathrm{p}(x) = (3x + 2) \times \mathrm{q}(x)$. [1]

View solution

(d) Hence find $\mathrm{p}(x)$ as a product of linear factors with integer coefficients. [1]

View solution

© UCLES 2022

5 A geometric progression is such that the fifteenth term is equal to $\frac{1}{8}$ of the twelfth term. The sum to infinity is 5.

(a) Find the first term and the common ratio. [4]

View solution

(b) Find the least number of terms needed for the sum of the geometric progression to be greater than 4.999. [3]

View solution

6 A function $f(x)$ is such that $f(x) = e^{3x} - 4$, for $x \in \mathbb{R}$.

(a) Find the range of f. [1]

View solution

(b) Find an expression for $f^{-1}(x)$. [2]

View solution

(c) On the axes, sketch the graphs of $y = f(x)$ and $y = f^{-1}(x)$ stating the exact values of the intercepts with the coordinate axes. [4]

View solution

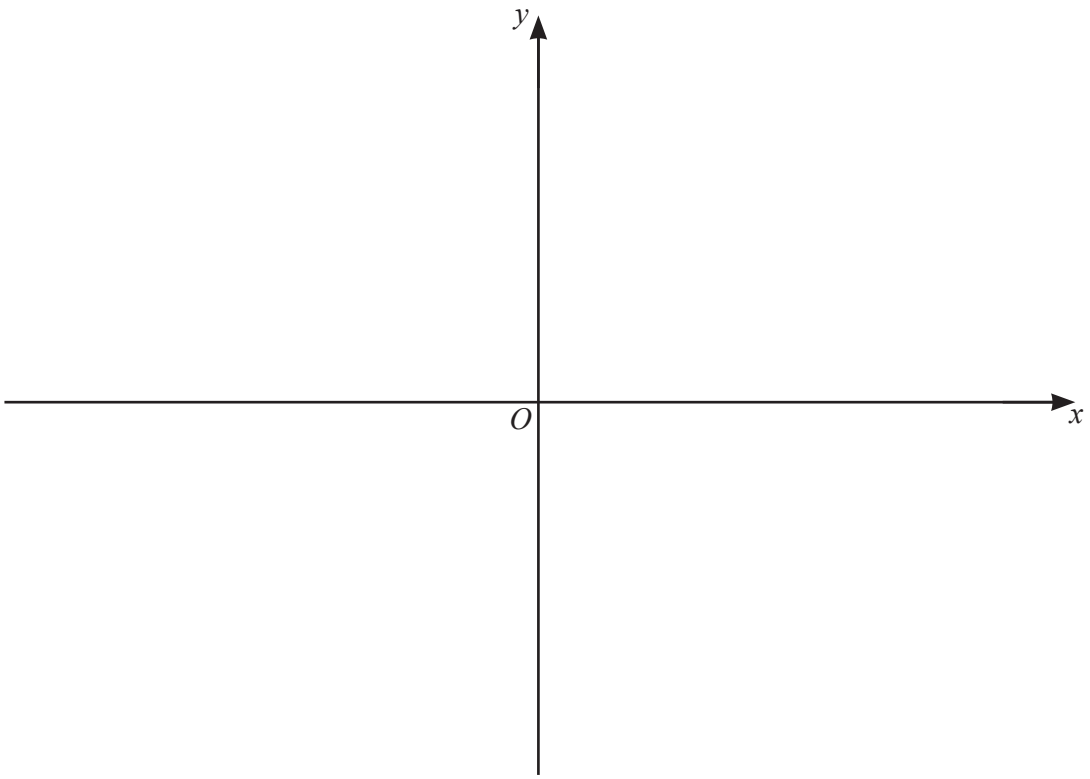

7 Find the exact value of $\int_0^{\frac{\pi}{2}} (\cos 3x + 4\sin 2x + 1)\,\mathrm{d}x$. [5]

View solution

8 In this question all lengths are in metres.

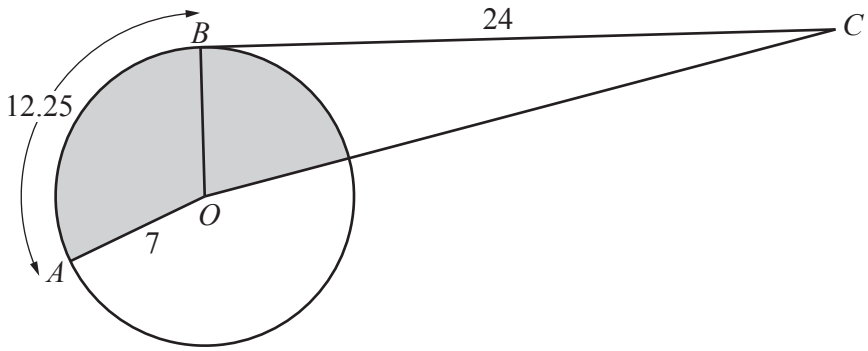

The diagram shows a circle, centre O, radius 7. The points A and B lie on the circumference of the circle. The line BC is a tangent to the circle at the point B such that the length of BC is 24. The length of the minor arc AB is 12.25.

(a) Find the obtuse angle AOB, giving your answer in radians. [1]

View solution

(b) Find the perimeter of the shaded region. [4]

View solution

(c) Find the area of the shaded region. [2]

View solution

9 A 6-character password is to be formed from the following characters.

Letters	A	B	C	D
Numbers	1	2	3	4
Symbols	*	#	$	£

No character may be used more than once in any password.

(a) (i) Find the number of different 6-character passwords that can be formed. [1]

View solution

(ii) How many of these 6-character passwords end with a symbol? [1]

View solution

(b) Find the number of different 6-character passwords that include all the symbols, but do not start or end with a symbol. [2]

View solution

© UCLES 2022

10 Solve the equation $\sqrt{2}\cos(3x+1.2) = 2\sin(3x+1.2)$, where x is in radians, for $-1.5 \leqslant x \leqslant 1.5$. [5]

View solution

11 It is given that $\int_1^a \left(\frac{3}{3x+2} - \frac{2}{2x+1} - \frac{1}{x}\right) \mathrm{d}x = \ln\frac{1}{5}$, where $a > 1$. Find the exact value of a. [6]

View solution

12 It is given that $y = \dfrac{\left(3x^2-2\right)^{\frac{2}{3}}}{x-1}$, for $x > 1$.

(a) Write $\dfrac{\mathrm{d}y}{\mathrm{d}x}$ in the form $\dfrac{\left(3x^2-2\right)^{-\frac{1}{3}}}{\left(x-1\right)^2}\left(x^2+Ax+B\right)$, where A and B are integers. [5]

View solution

(b) Find the approximate increase in y as x increases from 2 to $2+p$, where p is small. [2]

View solution

13 The points P and Q have coordinates $(5, -12)$ and $(15, -6)$ respectively. The point R lies on the line l, the perpendicular bisector of the line PQ. The x-coordinate of R is 7.

(a) Find the y-coordinate of R. [4]

View solution

(b) The point S lies on l such that its distance from PQ is 3 times the distance of R from PQ. Find the coordinates of the two possible positions of S. [3]

View solution

BLANK PAGE

Permission to reproduce items where third-party owned material protected by copyright is included has been sought and cleared where possible. Every reasonable effort has been made by the publisher (UCLES) to trace copyright holders, but if any items requiring clearance have unwittingly been included, the publisher will be pleased to make amends at the earliest possible opportunity.

To avoid the issue of disclosure of answer-related information to candidates, all copyright acknowledgements are reproduced online in the Cambridge Assessment International Education Copyright Acknowledgements Booklet. This is produced for each series of examinations and is freely available to download at www.cambridgeinternational.org after the live examination series.

Cambridge Assessment International Education is part of Cambridge Assessment. Cambridge Assessment is the brand name of the University of Cambridge Local Examinations Syndicate (UCLES), which is a department of the University of Cambridge.

© UCLES 2022