Cambridge Assessment International Education

Cambridge IGCSE™

CANDIDATE NAME									
CENTRE NUMBER						CANDIDATE NUMBER				

ADDITIONAL MATHEMATICS **0606/11**

Paper 1 **October/November 2024**

2 hours

You must answer on the question paper.

No additional materials are needed.

INSTRUCTIONS

- Answer **all** questions.
- Use a black or dark blue pen. You may use an HB pencil for any diagrams or graphs.
- Write your name, centre number and candidate number in the boxes at the top of the page.
- Write your answer to each question in the space provided.
- Do **not** use an erasable pen or correction fluid.
- Do **not** write on any bar codes.
- You should use a calculator where appropriate.
- You must show all necessary working clearly; no marks will be given for unsupported answers from a calculator.
- Give non-exact numerical answers correct to 3 significant figures, or 1 decimal place for angles in degrees, unless a different level of accuracy is specified in the question.

INFORMATION

- The total mark for this paper is 80.
- The number of marks for each question or part question is shown in brackets [ ].

This document has **16** pages. Any blank pages are indicated.

© UCLES 2024

Mathematical Formulae

1. ALGEBRA

Quadratic Equation

For the equation $ax^2 + bx + c = 0$,

$$x = \frac{-b \pm \sqrt{b^2 - 4ac}}{2a}$$

Binomial Theorem

$$(a+b)^n = a^n + \binom{n}{1}a^{n-1}b + \binom{n}{2}a^{n-2}b^2 + \ldots + \binom{n}{r}a^{n-r}b^r + \ldots + b^n$$

where n is a positive integer and $\binom{n}{r} = \frac{n!}{(n-r)!r!}$

Arithmetic series

$$u_n = a + (n-1)d$$

$$S_n = \frac{1}{2}n(a+l) = \frac{1}{2}n\{2a + (n-1)d\}$$

Geometric series

$$u_n = ar^{n-1}$$

$$S_n = \frac{a(1-r^n)}{1-r} \quad (r \neq 1)$$

$$S_\infty = \frac{a}{1-r} \quad (|r| < 1)$$

2. TRIGONOMETRY

Identities

$$\sin^2 A + \cos^2 A = 1$$
$$\sec^2 A = 1 + \tan^2 A$$
$$\operatorname{cosec}^2 A = 1 + \cot^2 A$$

Formulae for ΔABC

$$\frac{a}{\sin A} = \frac{b}{\sin B} = \frac{c}{\sin C}$$

$$a^2 = b^2 + c^2 - 2bc\cos A$$

$$\Delta = \frac{1}{2}bc\sin A$$

© UCLES 2024

1

View solution

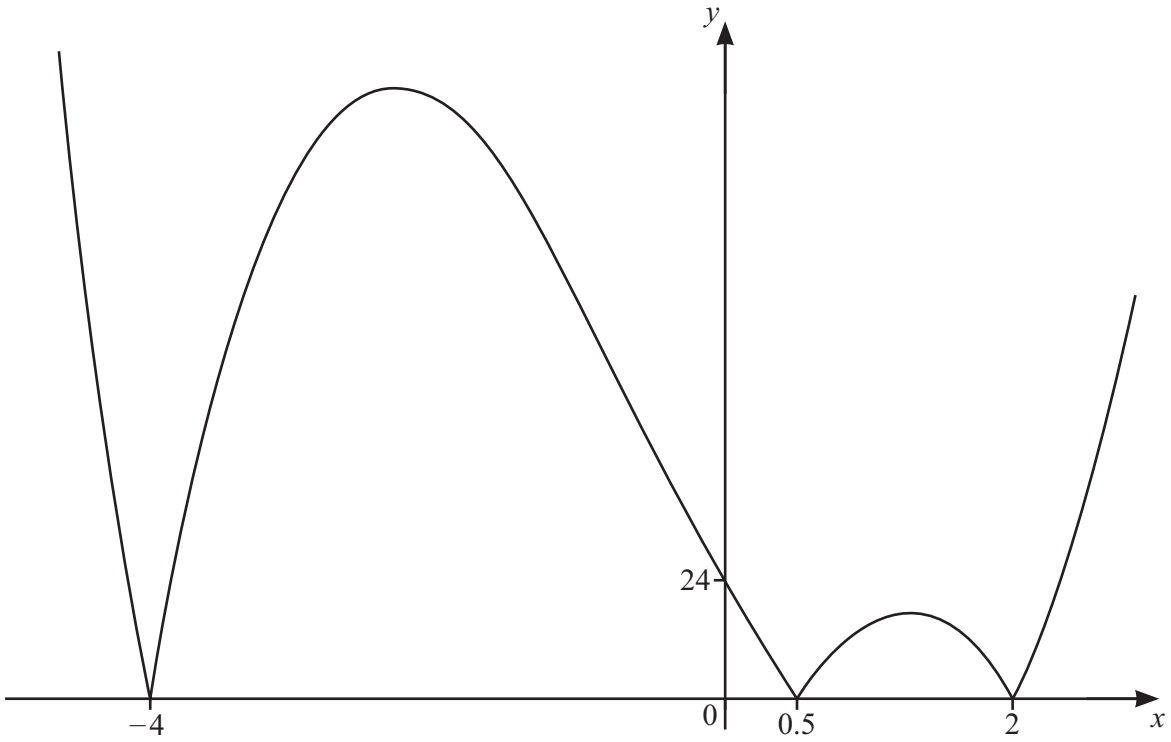

The diagram shows the graph of $y = |f(x)|$, where $f(x)$ is a cubic polynomial. Find the two possible expressions for $f(x)$ in terms of linear factors with integer coefficients. [3]

© UCLES 2024

2 **(a)** Given that $256^{x+y} \times 16^{-2x} = 8^{-x+3y}$, show that $y = 3x$. [2]

View solution

(b) Hence find the exact solutions of the following simultaneous equations.

View solution

$$256^{x+y} \times 16^{-2x} = 8^{-x+3y}$$

$$x^2 + 3y^2 = 56$$

[3]

3

View solution

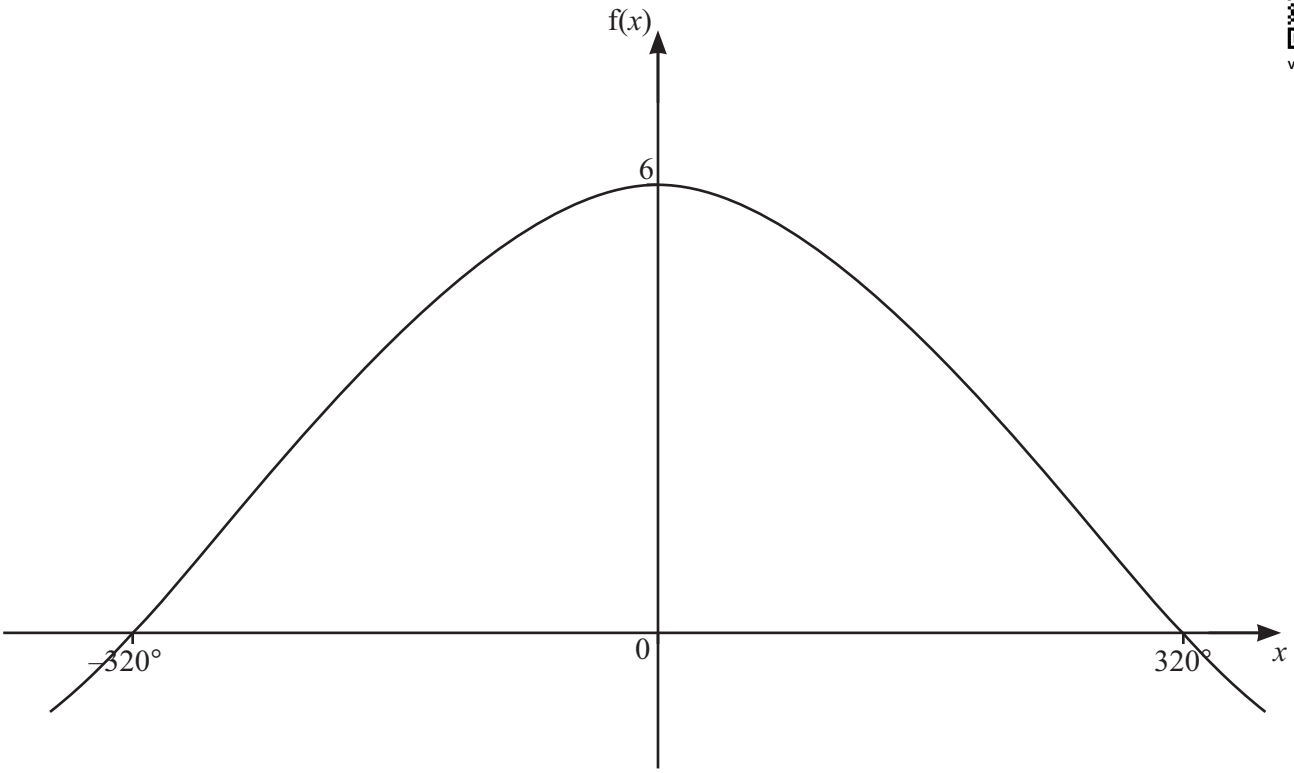

The diagram shows part of the graph of $f(x) = a\cos bx + c$, where a, b and c are constants. Given that $f(x)$ has a period of 960°, find the values of a, b and c. [4]

4 Given that $\int_0^{2a+1} \frac{8}{4x+3}\,\mathrm{d}x = \ln 16$, find the exact value of the constant a. [5]

View solution

5 **(a)** In the expansion of $(1+kx)^{15}$, where k is a constant, the coefficient of x^3 is $-29\,120$. Find the value of k. [2]

View solution

(b) Find the term independent of y in the expansion of $\left(8y^2 - \frac{1}{2y}\right)^{12}$. [2]

View solution

© UCLES 2024

6 The polynomial p is such that $\mathrm{p}(x) = ax^3 + 11x^2 + bx + c$, where a, b and c are integers.
It is given that $\mathrm{p}'(0) = 12$.
It is also given that $x + 3$ is a factor of p.
When p is divided by $x - 1$ the remainder is 16.

View solution

Find the values of a, b and c. [6]

7 When e^{5y} is plotted against x^3, a straight line passing through the points $(-2.56, 4.38)$ and $(6.54, 9.84)$ is obtained.

(a) Find y in terms of x. [5]

View solution

(b) Find the values of x for which y can exist. [3]

View solution

© UCLES 2024

8 Given that $f''(x) = (3x+5)^{-\frac{2}{3}}$, $f'(1) = 6$, and $f(1) = 20$, find an expression for $f(x)$. [8]

View solution

9 The equation of a curve is $y = \dfrac{e^{-3x+2}}{x+1}$ where $x < -1$.

(a) Show that $\dfrac{dy}{dx} = \dfrac{e^{-3x+2}}{(x+1)^2}(Ax+B)$ where A and B are integers to be found. [5]

View solution

(b) Hence show that there is only one stationary point on the curve and find its exact coordinates. [3]

View solution

10 **(a)** The 3rd and 8th terms of a geometric progression are 6 and 1458 respectively. Find the common ratio and the first term of this progression. [4]

View solution

(b) The first 3 terms of a second geometric progression are $\cos\theta$, $2\cos^2\theta$, $4\cos^3\theta$, where $-90° < \theta < 90°$. Find the values of θ for which this geometric progression has a sum to infinity. [4]

View solution

11

View solution

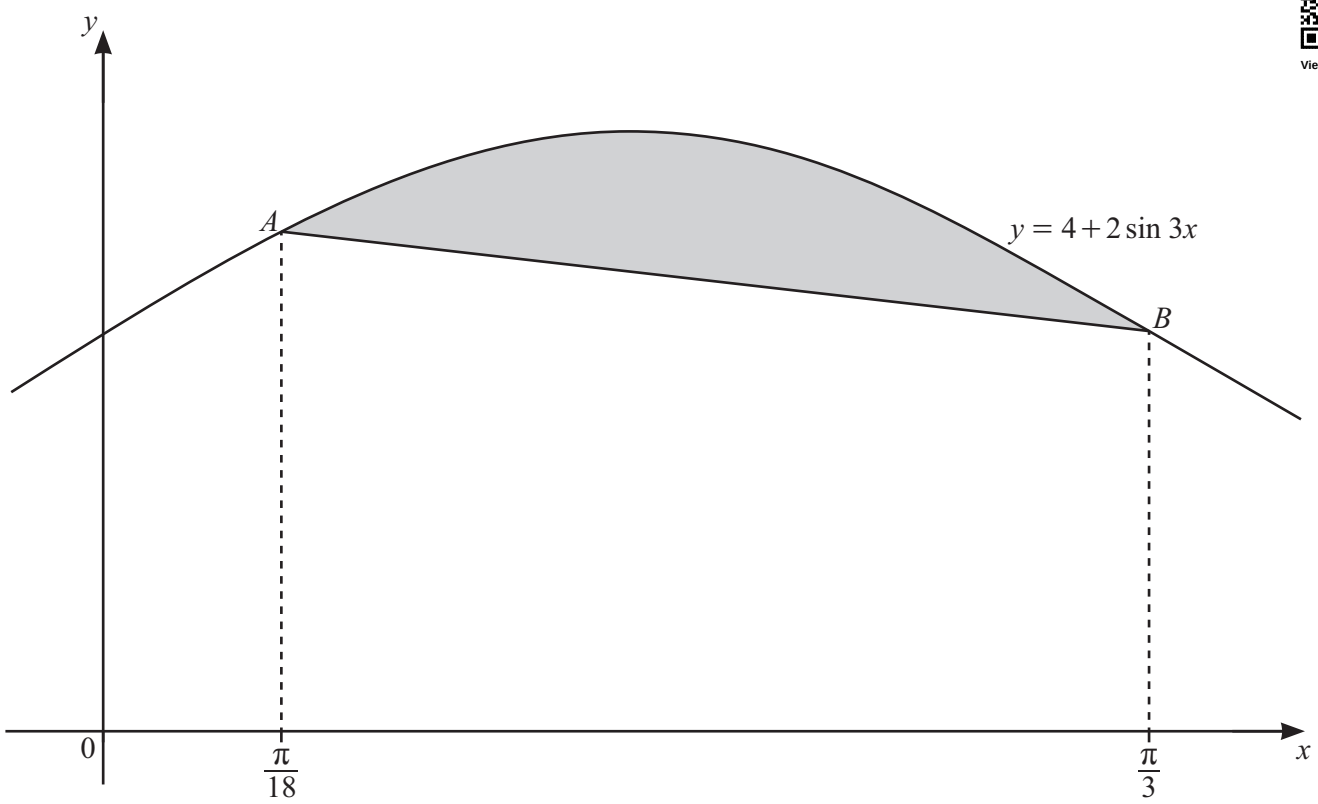

The diagram shows part of the curve $y = 4 + 2\sin 3x$ and the straight line AB. The points A and B lie on the curve. The x-coordinate of A is $\frac{\pi}{18}$ and the x-coordinate of B is $\frac{\pi}{3}$. Find the area of the shaded region, giving your answer in exact form. [9]

Continuation of working space for Question 11.

© UCLES 2024

12 **(a)** Solve the equation $2\operatorname{cosec}^2\theta - 5 = 5\cot\theta$ for $-180° \leqslant \theta \leqslant 180°$. [7]

View solution

(b) Solve the equation $3\sin(2\phi + 1.5) = 2$ for $0 < \phi < 5$, where ϕ is in radians. [5]

View solution

BLANK PAGE

Permission to reproduce items where third-party owned material protected by copyright is included has been sought and cleared where possible. Every reasonable effort has been made by the publisher (UCLES) to trace copyright holders, but if any items requiring clearance have unwittingly been included, the publisher will be pleased to make amends at the earliest possible opportunity.

To avoid the issue of disclosure of answer-related information to candidates, all copyright acknowledgements are reproduced online in the Cambridge Assessment International Education Copyright Acknowledgements Booklet. This is produced for each series of examinations and is freely available to download at www.cambridgeinternational.org after the live examination series.

Cambridge Assessment International Education is part of Cambridge Assessment. Cambridge Assessment is the brand name of the University of Cambridge Local Examinations Syndicate (UCLES), which is a department of the University of Cambridge.

© UCLES 2024