Cambridge Assessment International Education

Cambridge IGCSE™

CANDIDATE NAME									
CENTRE NUMBER						CANDIDATE NUMBER				

ADDITIONAL MATHEMATICS **0606/12**

Paper 1 **October/November 2024**

2 hours

You must answer on the question paper.

No additional materials are needed.

INSTRUCTIONS

- Answer **all** questions.
- Use a black or dark blue pen. You may use an HB pencil for any diagrams or graphs.
- Write your name, centre number and candidate number in the boxes at the top of the page.
- Write your answer to each question in the space provided.
- Do **not** use an erasable pen or correction fluid.
- Do **not** write on any bar codes.
- You should use a calculator where appropriate.
- You must show all necessary working clearly; no marks will be given for unsupported answers from a calculator.
- Give non-exact numerical answers correct to 3 significant figures, or 1 decimal place for angles in degrees, unless a different level of accuracy is specified in the question.

INFORMATION

- The total mark for this paper is 80.
- The number of marks for each question or part question is shown in brackets [ ].

This document has **16** pages. Any blank pages are indicated.

© UCLES 2024

Mathematical Formulae

1. ALGEBRA

Quadratic Equation

For the equation $ax^2 + bx + c = 0$,

$$x = \frac{-b \pm \sqrt{b^2 - 4ac}}{2a}$$

Binomial Theorem

$$(a+b)^n = a^n + \binom{n}{1}a^{n-1}b + \binom{n}{2}a^{n-2}b^2 + \ldots + \binom{n}{r}a^{n-r}b^r + \ldots + b^n$$

where n is a positive integer and $\binom{n}{r} = \frac{n!}{(n-r)!r!}$

Arithmetic series

$$u_n = a + (n-1)d$$

$$S_n = \frac{1}{2}n(a+l) = \frac{1}{2}n\{2a + (n-1)d\}$$

Geometric series

$$u_n = ar^{n-1}$$

$$S_n = \frac{a(1-r^n)}{1-r} \quad (r \neq 1)$$

$$S_\infty = \frac{a}{1-r} \quad (|r| < 1)$$

2. TRIGONOMETRY

Identities

$$\sin^2 A + \cos^2 A = 1$$
$$\sec^2 A = 1 + \tan^2 A$$
$$\operatorname{cosec}^2 A = 1 + \cot^2 A$$

Formulae for ΔABC

$$\frac{a}{\sin A} = \frac{b}{\sin B} = \frac{c}{\sin C}$$

$$a^2 = b^2 + c^2 - 2bc\cos A$$

$$\Delta = \frac{1}{2}bc\sin A$$

© UCLES 2024

1 The curve $y = a\cos bx + c$, where a, b and c are integers, passes through the points $\left(-\frac{\pi}{6}, -2\right)$ and $\left(\frac{\pi}{9}, \frac{1}{2}\right)$. The curve has a period of $\frac{2\pi}{3}$.

(a) Find the values of a, b and c. [4]

View solution

(b) Find the least value of y on the curve for $0 \leqslant x \leqslant \frac{\pi}{2}$, and state the value of x at which this occurs. [3]

View solution

© UCLES 2024

2 It is given that $y = \mathrm{f}(x)$, where $\mathrm{f}(x) = (2x-5)(x-1)^2$.

(a) Find the coordinates of the stationary points on the curve $y = \mathrm{f}(x)$. [4]

View solution

(b) On the axes, sketch the graph of $y = \mathrm{f}(x)$, stating the intercepts with the axes. [3]

View solution

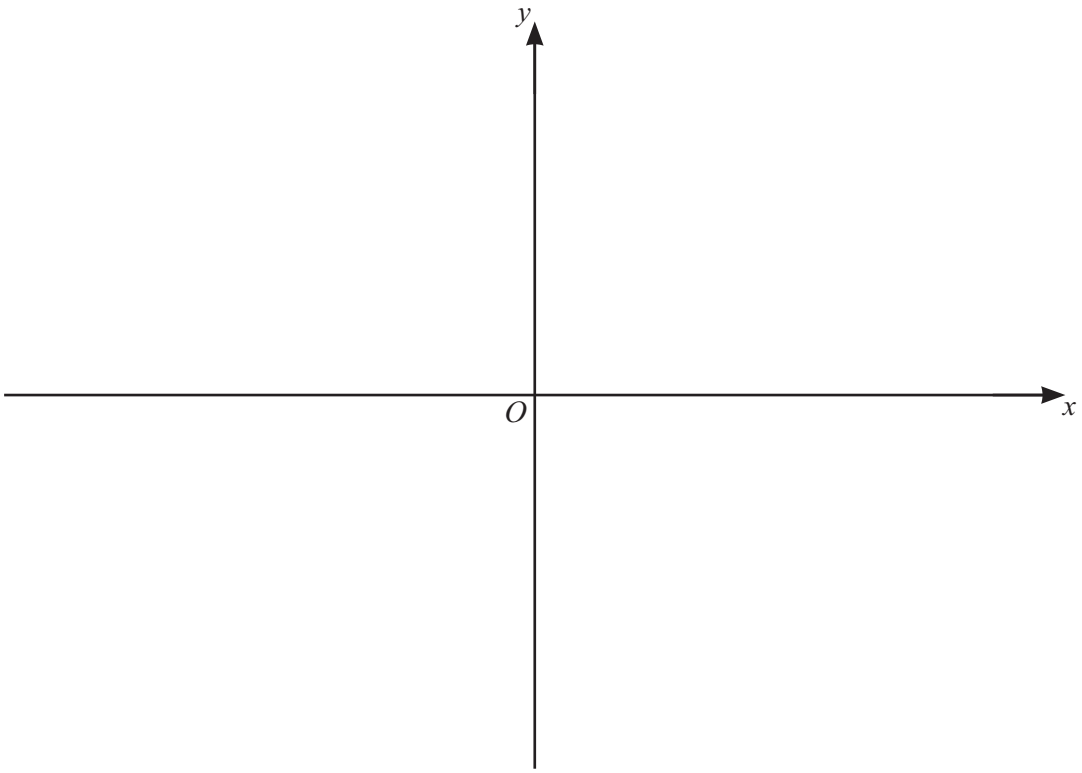

(c) Hence find the values of k for which $\mathrm{f}(x) = k$ has exactly one solution. [2]

View solution

© UCLES 2024

3 In this question, all lengths are in centimetres and all angles are in radians.

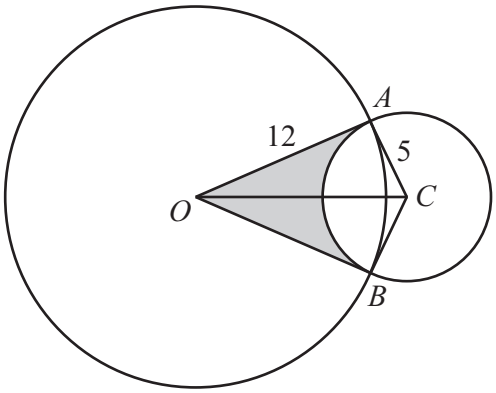

The diagram shows a circle with centre O and radius 12, and a circle with centre C and radius 5.
The circles intersect at the points A and B, such that OA and OB are tangents to the circle with centre C.

(a) Show that the obtuse angle ACB is 2.35 radians, correct to 2 decimal places. [2]

View solution

(b) Find the perimeter of the shaded region. [2]

View solution

(c) Find the area of the shaded region. [3]

View solution

4 The function f is such that $\mathrm{f}(x) = 4\ln(3x-2)$, for $x > a$, where a is as small as possible.

(a) (i) Write down the value of a. [1]

View solution

(ii) Write down the range of f. [1]

View solution

(iii) Find $\mathrm{f}^{-1}(x)$, stating its domain and range. [4]

View solution

(iv) On the axes sketch the graphs of $y = \mathrm{f}(x)$ and $y = \mathrm{f}^{-1}(x)$, stating the intercepts with the axes. [4]

View solution

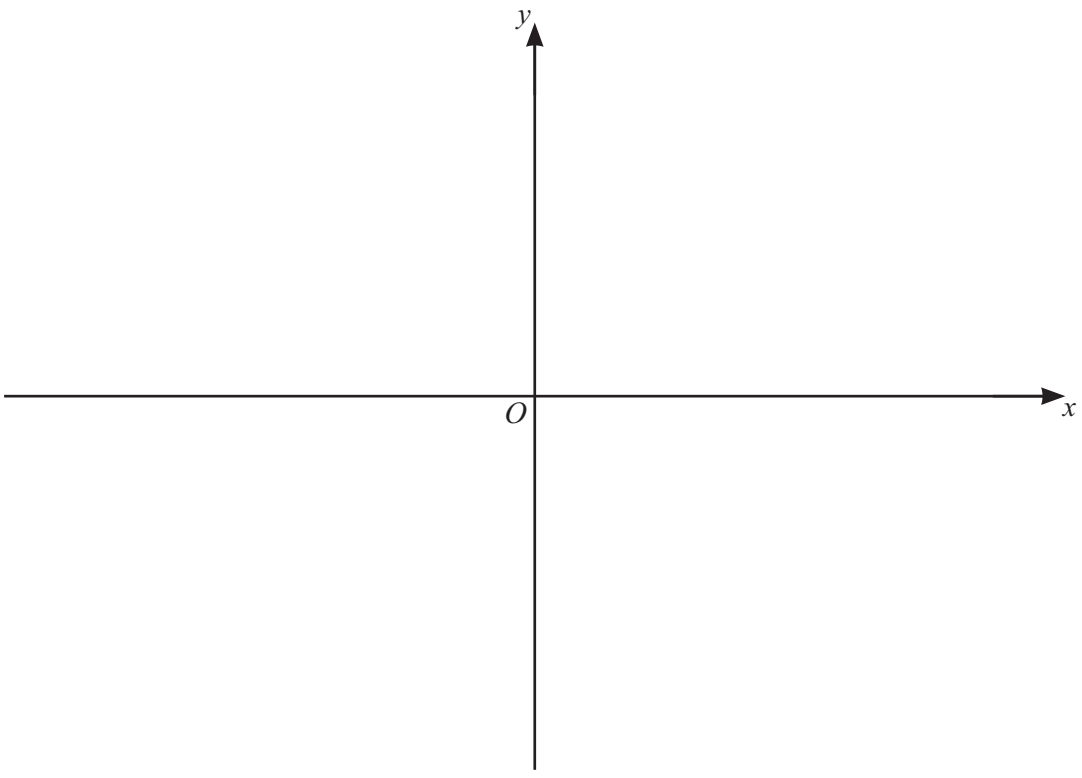

(b) Given that $g(x) = (2x+1)^{\frac{1}{2}} + 4$, for $x > 0$, solve the equation $gg(x) = 9$. [3]

View solution

5 **(a)** Show that $\dfrac{1+\cot^2\theta}{\cot^2\theta} = \sec^2\theta$. [1]

View solution

(b) Write down the derivative of $\tan\theta$ with respect to θ. [1]

View solution

(c) Using **part (a)** and **part (b)**, find the exact value of $\displaystyle\int_0^{\frac{\pi}{3}} \left(\frac{1+\cot^2\theta}{\cot^2\theta} - \sin\theta \right) \mathrm{d}\theta$. [4]

View solution

© UCLES 2024

6 **(a)** Find, in descending powers of x, the first 3 terms in the expansion of $\left(x+\frac{2}{x^2}\right)^{10}$. Simplify each term as far as possible. [3]

View solution

(b) Find the term independent of x in the expansion of $\left(4x^2+\frac{1}{2x^2}\right)^8$. [2]

View solution

© UCLES 2024

7 It is given that $y = \dfrac{\ln(3x^2 - 1)}{x + 2}$, for $x > \dfrac{1}{\sqrt{3}}$. When $x = 1$, y is increasing at the rate of h units per second. Find, in terms of h, the corresponding rate of change in x, giving your answer in exact form.

[6]

View solution

8 The tangent to the curve $y = e^x(2x+5)^{\frac{1}{2}}$ at the point where $x = 2$ meets the x-axis at the point X and the y-axis at the point Y. Find the coordinates of the mid-point of XY, giving your answer in exact form. [8]

View solution

9

View solution

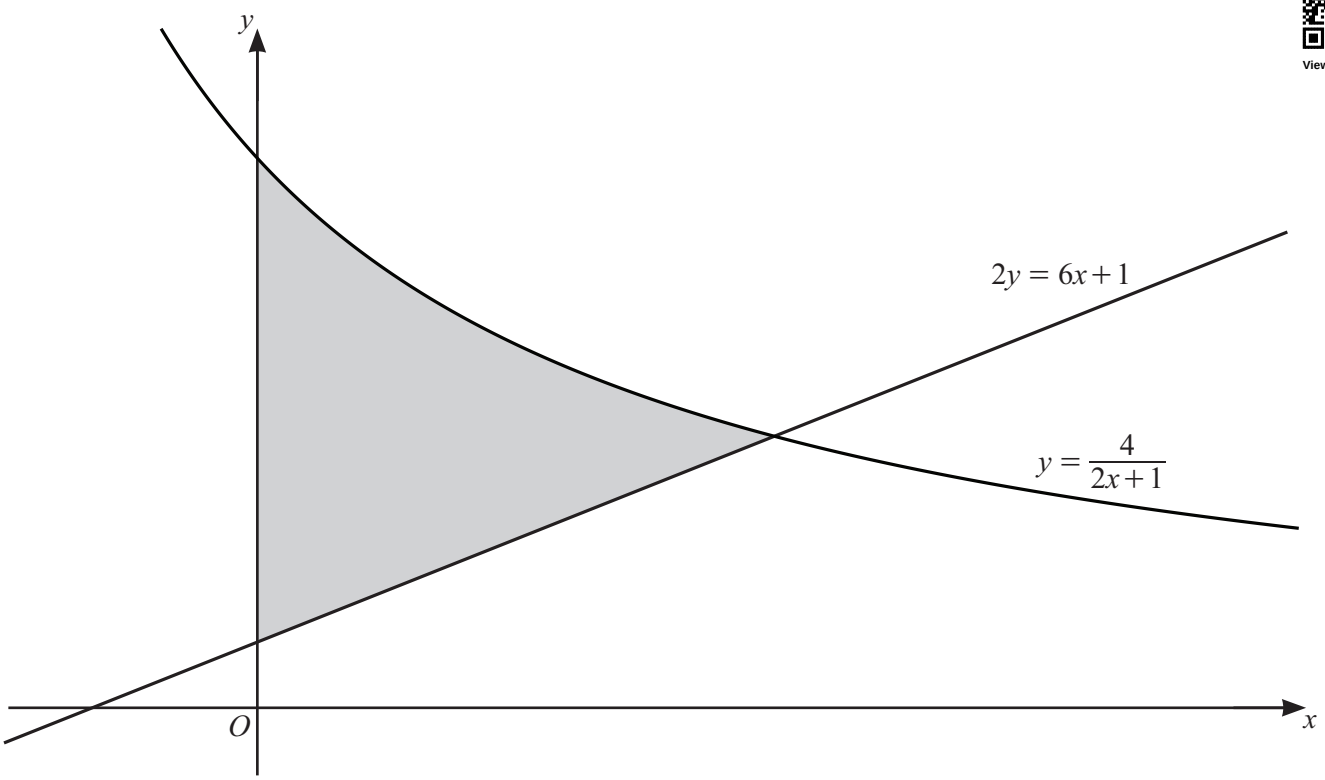

The diagram shows part of the curve $y = \frac{4}{2x+1}$ and the straight line $2y = 6x + 1$. Find the area of the shaded region, giving your answer in the form $\ln a + b$, where a is an integer and b is a rational number. [8]

Continuation of working space for question 9.

10 **(a)** The first 3 terms of an arithmetic progression are $2\tan 2x$, $5\tan 2x$, $8\tan 2x$. Find the values of x, where $-180° \leqslant x \leqslant 180°$, for which the sum to 30 terms is $455\sqrt{3}$. [5]

View solution

(b) The first 3 terms of a geometric progression are

View solution

$$5\cos^2\left(\theta-\frac{\pi}{2}\right), \quad 20\cos^4\left(\theta-\frac{\pi}{2}\right), \quad 80\cos^6\left(\theta-\frac{\pi}{2}\right), \quad \text{where } -\frac{\pi}{6}\leqslant\theta\leqslant\frac{7\pi}{6}.$$

Find the values of θ for which this geometric progression has a sum to infinity. [6]

© UCLES 2024

BLANK PAGE

Permission to reproduce items where third-party owned material protected by copyright is included has been sought and cleared where possible. Every reasonable effort has been made by the publisher (UCLES) to trace copyright holders, but if any items requiring clearance have unwittingly been included, the publisher will be pleased to make amends at the earliest possible opportunity.

To avoid the issue of disclosure of answer-related information to candidates, all copyright acknowledgements are reproduced online in the Cambridge Assessment International Education Copyright Acknowledgements Booklet. This is produced for each series of examinations and is freely available to download at www.cambridgeinternational.org after the live examination series.

Cambridge Assessment International Education is part of Cambridge Assessment. Cambridge Assessment is the brand name of the University of Cambridge Local Examinations Syndicate (UCLES), which is a department of the University of Cambridge.

© UCLES 2024