Cambridge Assessment International Education

Cambridge IGCSE™

CANDIDATE NAME									
CENTRE NUMBER						CANDIDATE NUMBER				

ADDITIONAL MATHEMATICS **0606/23**

Paper 2 **October/November 2024**

2 hours

You must answer on the question paper.

No additional materials are needed.

INSTRUCTIONS

- Answer **all** questions.
- Use a black or dark blue pen. You may use an HB pencil for any diagrams or graphs.
- Write your name, centre number and candidate number in the boxes at the top of the page.
- Write your answer to each question in the space provided.
- Do **not** use an erasable pen or correction fluid.
- Do **not** write on any bar codes.
- You should use a calculator where appropriate.
- You must show all necessary working clearly; no marks will be given for unsupported answers from a calculator.
- Give non-exact numerical answers correct to 3 significant figures, or 1 decimal place for angles in degrees, unless a different level of accuracy is specified in the question.

INFORMATION

- The total mark for this paper is 80.
- The number of marks for each question or part question is shown in brackets [ ].

This document has **16** pages. Any blank pages are indicated.

© UCLES 2024

Mathematical Formulae

1. ALGEBRA

Quadratic Equation

For the equation $ax^2 + bx + c = 0$,

$$x = \frac{-b \pm \sqrt{b^2 - 4ac}}{2a}$$

Binomial Theorem

$$(a+b)^n = a^n + \binom{n}{1}a^{n-1}b + \binom{n}{2}a^{n-2}b^2 + \ldots + \binom{n}{r}a^{n-r}b^r + \ldots + b^n$$

where n is a positive integer and $\binom{n}{r} = \frac{n!}{(n-r)!r!}$

Arithmetic series $u_n = a + (n-1)d$

$$S_n = \frac{1}{2}n(a+l) = \frac{1}{2}n\{2a + (n-1)d\}$$

Geometric series $u_n = ar^{n-1}$

$$S_n = \frac{a(1-r^n)}{1-r} \quad (r \neq 1)$$

$$S_\infty = \frac{a}{1-r} \quad (|r| < 1)$$

2. TRIGONOMETRY

Identities

$$\sin^2 A + \cos^2 A = 1$$
$$\sec^2 A = 1 + \tan^2 A$$
$$\operatorname{cosec}^2 A = 1 + \cot^2 A$$

Formulae for ΔABC

$$\frac{a}{\sin A} = \frac{b}{\sin B} = \frac{c}{\sin C}$$

$$a^2 = b^2 + c^2 - 2bc\cos A$$

$$\Delta = \frac{1}{2}bc\sin A$$

© UCLES 2024

1

View solution

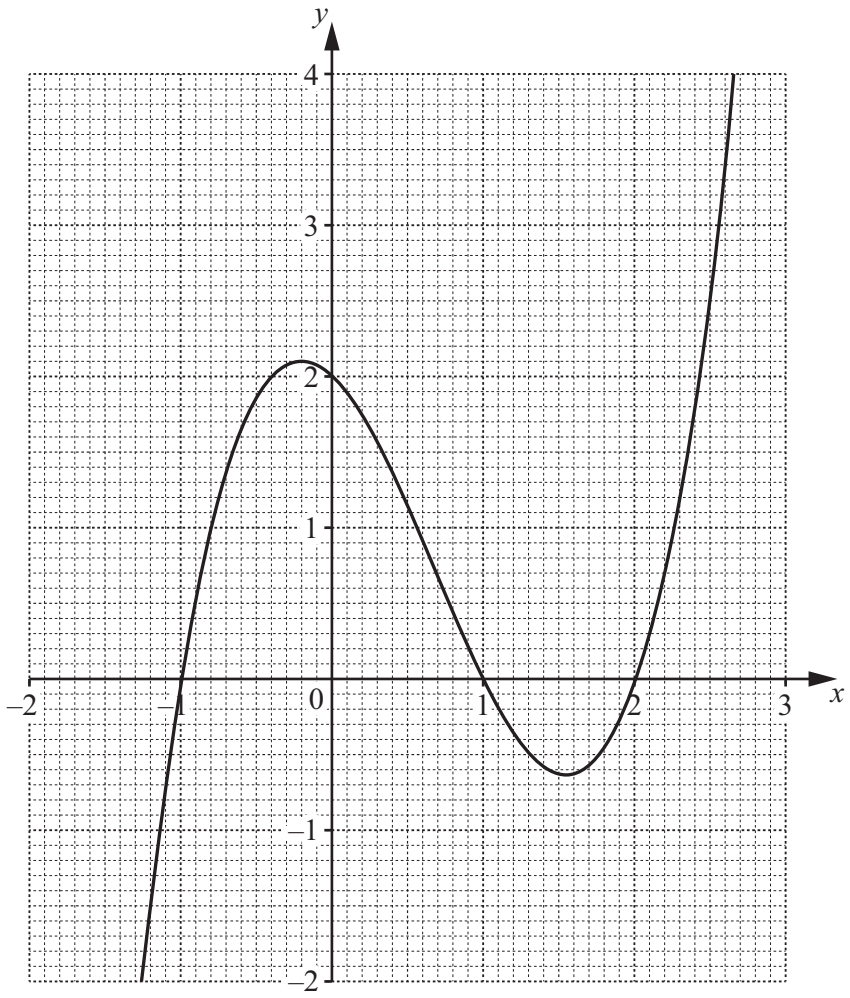

The diagram shows the graph of $y = (x+1)(x-1)(x-2)$. Use the graph to solve the inequality $(x+1)(x-1)(x-2) < 1$. [3]

2 The function f is defined by $f(x) = 1 - 4x - x^2$ for all real values of x.

(a) Write $f(x)$ in the form $a - (x + b)^2$, where a and b are constants. [2]

View solution

(b) Find the range of f. [1]

View solution

The function g is defined by $g(x) = 1 - 4x - x^2$ for $x \geqslant k$, where k is a constant.

(c) State the least possible value of k such that g has an inverse. [1]

View solution

(d) Using your value of k, find $g^{-1}(x)$, stating its domain and range. [5]

View solution

© UCLES 2024

3 **(a)** Show that $(2\tan\theta+\sec\theta)(2\tan\theta-\sec\theta) = 3\tan^2\theta - 1$. [2]

View solution

(b) Hence solve the equation $(2\tan\theta+\sec\theta)(2\tan\theta-\sec\theta) = 1$ for $0° \leqslant \theta \leqslant 180°$. [4]

View solution

4 The diagram shows a design for a logo. The logo is a sector of a circle, radius r cm, with angle α radians.

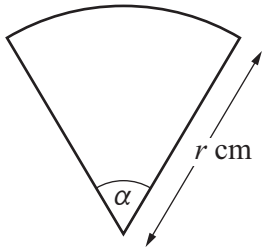

The area of the logo is $9\,\text{cm}^2$.

(a) Show that the perimeter, P cm, of the logo is given by

$$P = 2r + \frac{18}{r}.$$ [3]

View solution

(b) Given that r can vary, find the stationary value of P and determine its nature. [5]

View solution

5 The tangent to the curve $y = \frac{\sqrt{x+1}}{x}$ at the point where $x = 3$ meets the line $y = x - 16$ at the point A. Find the coordinates of A. [8]

View solution

© UCLES 2024

6 **(a)** Find $\int \frac{1}{\sqrt{3x+2}} \mathrm{d}x$. [2]

View solution

(b) Find, in terms of a, $\int_{0.5}^{a} \mathrm{e}^{(1-2x)} \mathrm{d}x$. [3]

View solution

7 **(a)** In the expansion of $\left(x+x^2\right)^8$ in ascending powers of x, the 3rd and 6th terms are equal.

Find the value of x. [3]

View solution

(b) In the expansion of $\left(x+\frac{2}{x}\right)^n$ in decreasing powers of x, the 6th term is a constant.

View solution

(i) Find the value of the positive integer n. [2]

(ii) Find the value of the 6th term. [2]

View solution

© UCLES 2024

8 **(a)** Solve the equation $\sin 4x = \frac{1}{2}$ for $0 \leqslant x \leqslant \frac{\pi}{4}$, giving your answers in terms of π. [2]

View solution

View solution

(b)

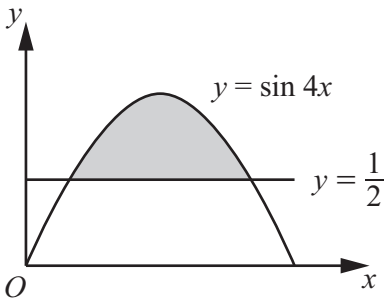

The diagram shows parts of the graphs of $y = \sin 4x$ and $y = \frac{1}{2}$.

Find the exact area of the shaded region enclosed by the curve and the line. [5]

© UCLES 2024

9 DO NOT USE A CALCULATOR IN THIS QUESTION.

Write $\dfrac{16+11\sqrt{10}}{2+\sqrt{10}}+1$ in the form $p+q\sqrt{10}$, where p and q are integers. [4]

View solution

10 **(a)** Suzma is training for a marathon. In the first week she runs 10 km. Then each week she runs a distance that is 10% greater than the week before.

The total distance that Suzma has run by the end of n whole weeks is more than 200 km. Find the smallest possible value of n. [4]

View solution

(b) A geometric progression has 1st term a and common ratio r, where $a \neq 0$ and $r \neq 1$. The 1st, 2nd and 3rd terms of the geometric progression are the 1st, 3rd and 7th terms of an arithmetic progression. Find the value of r. [4]

View solution

11 **(a)** There are 3 girls and 2 boys standing in a straight line. Find the number of possible orders in each of the following cases.

(i) No girls are next to each other. [2]

View solution

(ii) The 2 boys are not next to each other. [2]

View solution

(b) 12 people, including Anjie and Bubay, are divided into 3 groups of 4 people. Anjie and Bubay must not be in the same group.

Find the number of ways in which the 3 groups can be selected. [2]

View solution

12 A particle moves in a straight line. Its velocity, $v\,\text{ms}^{-1}$, at time t seconds is given by

$$v = \cos t - \sin t.$$

(a) Find the acceleration, $a\,\text{ms}^{-2}$, when $t = \frac{\pi}{3}$. [2]

View solution

The displacement of the particle from a fixed point O at time t is s metres. The particle passes through O when $t = 0$.

(b) Find the displacement at the time when the particle first changes direction after passing through O. [6]

View solution

(c) Find an expression for a in terms of s. [1]

View solution

BLANK PAGE

© UCLES 2024

BLANK PAGE

Permission to reproduce items where third-party owned material protected by copyright is included has been sought and cleared where possible. Every reasonable effort has been made by the publisher (UCLES) to trace copyright holders, but if any items requiring clearance have unwittingly been included, the publisher will be pleased to make amends at the earliest possible opportunity.

To avoid the issue of disclosure of answer-related information to candidates, all copyright acknowledgements are reproduced online in the Cambridge Assessment International Education Copyright Acknowledgements Booklet. This is produced for each series of examinations and is freely available to download at www.cambridgeinternational.org after the live examination series.

Cambridge Assessment International Education is part of Cambridge Assessment. Cambridge Assessment is the brand name of the University of Cambridge Local Examinations Syndicate (UCLES), which is a department of the University of Cambridge.

© UCLES 2024