Cambridge Assessment International Education

Cambridge IGCSE™

CANDIDATE NAME									
CENTRE NUMBER						CANDIDATE NUMBER			

ADDITIONAL MATHEMATICS **0606/13**

Paper 1 Non-calculator **October/November 2025**

2 hours

You must answer on the question paper.

No additional materials are needed.

INSTRUCTIONS

- Answer **all** questions.
- Use a black or dark blue pen. You may use an HB pencil for any diagrams or graphs.
- Write your name, centre number and candidate number in the boxes at the top of the page.
- Write your answer to each question in the space provided.
- Do **not** use an erasable pen or correction fluid.
- Do **not** write on any bar codes.
- Calculators must **not** be used in this paper.
- You must show all necessary working clearly.

INFORMATION

- The total mark for this paper is 80.
- The number of marks for each question or part question is shown in brackets [ ].

This document has **16** pages. Any blank pages are indicated.

© UCLES 2025

List of formulas

Equation of a circle with centre (a, b) and radius r. $(x-a)^2 + (y-b)^2 = r^2$

Curved surface area, A, of cone of radius r, sloping edge l. $A = \pi rl$

Surface area, A, of sphere of radius r. $A = 4\pi r^2$

Volume, V, of pyramid or cone, base area A, height h. $V = \frac{1}{3}Ah$

Volume, V, of sphere of radius r. $V = \frac{4}{3}\pi r^3$

Quadratic equation

For the equation $ax^2 + bx + c = 0$,

$$x = \frac{-b \pm \sqrt{b^2 - 4ac}}{2a}$$

Binomial theorem

$$(a+b)^n = a^n + \binom{n}{1}a^{n-1}b + \binom{n}{2}a^{n-2}b^2 + \ldots + \binom{n}{r}a^{n-r}b^r + \ldots + b^n,$$

where n is a positive integer and $\binom{n}{r} = \frac{n!}{(n-r)!r!}$

Arithmetic series

$$u_n = a + (n-1)d$$
$$S_n = \frac{1}{2}n(a+l) = \frac{1}{2}n\{2a + (n-1)d\}$$

Geometric series

$$u_n = ar^{n-1}$$
$$S_n = \frac{a(1-r^n)}{1-r} \quad (r \neq 1)$$
$$S_\infty = \frac{a}{1-r} \quad (|r| < 1)$$

Identities

$$\sin^2 A + \cos^2 A = 1$$
$$\sec^2 A = 1 + \tan^2 A$$
$$\operatorname{cosec}^2 A = 1 + \cot^2 A$$

Formulas for ΔABC

$$\frac{a}{\sin A} = \frac{b}{\sin B} = \frac{c}{\sin C}$$
$$a^2 = b^2 + c^2 - 2bc\cos A$$
$$\Delta = \frac{1}{2}ab\sin C$$

© UCLES 2025

Calculators must **not** be used in this paper.

1 Solve the following inequalities.

(a) $x^2 - x - 6 \geqslant 0$ [3]

View solution

(b) $|3x - 4| < x + 2$ [4]

View solution

2 Differentiate $x^2 e^{3x}$ with respect to x. [3]

View solution

3 In this question you may use the values in the table below.

View solution

θ radians	$\sin\theta$	$\cos\theta$	$\tan\theta$
$\frac{\pi}{6}$	$\frac{1}{2}$	$\frac{\sqrt{3}}{2}$	$\frac{\sqrt{3}}{3}$
$\frac{\pi}{3}$	$\frac{\sqrt{3}}{2}$	$\frac{1}{2}$	$\sqrt{3}$

Variables x and y are related by the equation $y = \sin 5x$ where $0 \leqslant x \leqslant \frac{\pi}{10}$.

Use calculus to find the approximate change in x when y increases from $\frac{\sqrt{3}}{2}$ by the small amount 0.01. [4]

© UCLES 2025

4

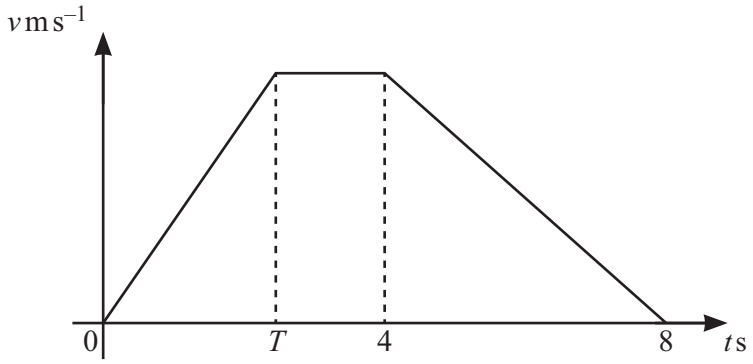

The velocity–time graph represents the motion of a particle moving in a straight line.
The acceleration during the first T seconds of the motion is $2\,\text{m s}^{-2}$.
The total distance travelled is 27 m.

(a) Calculate T. [4]

View solution

(b) Calculate the acceleration during the last 4 seconds of the motion. [2]

View solution

5 The normal to the curve $y = x^3 + \frac{3}{2}x^2 - 2x + 1$ at the point where $x = 0$ cuts the curve again at two other points.

Find the x-coordinates of these two points. [8]

View solution

6 (a)

View solution

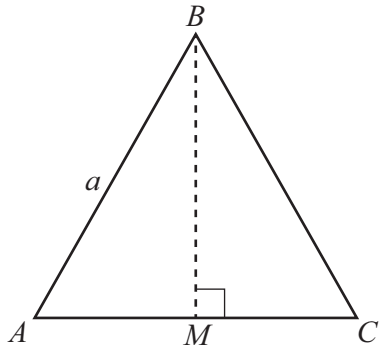

The diagram shows an equilateral triangle ABC with side a.
M is the midpoint of AC and angle $AMB = 90°$.

Use the diagram to find $\sec 30°$. [3]

(b) Show that $\dfrac{1}{\sec x - 1} + \dfrac{1}{\sec x + 1}$ can be written as $2\,\mathrm{cosec}\,x \cot x$. [4]

View solution

7 The point O is the origin.
Two points P and Q are such that $\overrightarrow{PQ}$ is in the same direction as $-\mathbf{i}+5\mathbf{j}$.

(a) The point R is such that $\overrightarrow{OR}$ is in the same direction as $\overrightarrow{PQ}$ and the magnitude of $\overrightarrow{OR}$ is $3\sqrt{26}$.

View solution

Find $\overrightarrow{OR}$. [3]

(b) $\overrightarrow{OP}$ is in the same direction as $2\mathbf{i}-3\mathbf{j}$ and $\overrightarrow{OQ}=10\mathbf{i}+6\mathbf{j}$.

View solution

Find $\overrightarrow{OP}$. [4]

© UCLES 2025

8

View solution

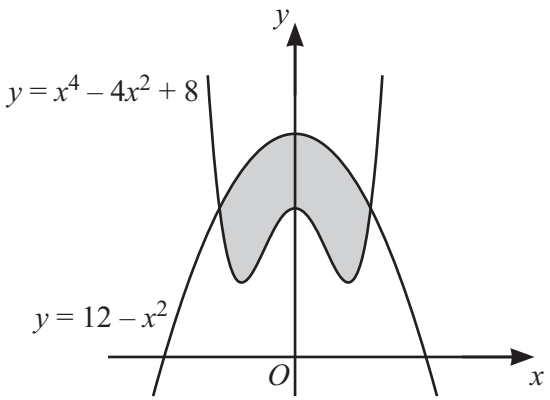

The diagram shows part of each of the curves $y = 12 - x^2$ and $y = x^4 - 4x^2 + 8$.

Find the area of the shaded region enclosed by the two curves. [7]

© UCLES 2025

9 Solve the following equations.

(a) $\log_5(5x-2) - \log_{25} x = \frac{1}{2}$ [5]

View solution

(b) $e^{3y-7} + \frac{4}{e^3} = \frac{5}{e^{3y-1}}$ [6]

View solution

10 **(a)** An arithmetic progression has first term a and common difference d.

Given that $S_{20} = 3 \times S_{10}$, find a in terms of d. [3]

View solution

(b) A geometric progression, A, has common ratio r, where $|r| < 1$.
The terms of this progression are $a_1, a_2, a_3 \ldots$.

View solution

Another geometric progression, B, has terms $b_1, b_2, b_3 \ldots$, where

$$b_1 = a_2, \quad b_2 = a_4, \quad b_3 = a_6 \ldots .$$

The sum to infinity of A is S_A and the sum to infinity of B is S_B.

Find $\frac{S_B}{S_A}$ in terms of r.

Give your answer in its simplest form. [5]

11 The lines $x = 0$, $x = 4$, $y = 3$ and $y = -1$ are tangents to a circle.

(a) Find the equation of the circle. [3]

View solution

The line $y = 2x + a$, where a is a constant, is also a tangent to the circle.

(b) Show that $5x^2 + 4(a-2)x + (a-1)^2 = 0$, and hence find the possible values of a. Give your answers in exact form. [4]

View solution

12 **(a)** Write down the coefficient of x^r in the binomial expansion of $(2+x)^{59}$. [1]

View solution

(b) For this expansion, find the value of r for which the coefficient of x^r is equal to the coefficient of x^{r+1}. [4]

View solution

BLANK PAGE

Permission to reproduce items where third-party owned material protected by copyright is included has been sought and cleared where possible. Every reasonable effort has been made by the publisher (UCLES) to trace copyright holders, but if any items requiring clearance have unwittingly been included, the publisher will be pleased to make amends at the earliest possible opportunity.

To avoid the issue of disclosure of answer-related information to candidates, all copyright acknowledgements are reproduced online in the Cambridge Assessment International Education Copyright Acknowledgements Booklet. This is produced for each series of examinations and is freely available to download at www.cambridgeinternational.org after the live examination series.

Cambridge Assessment International Education is part of Cambridge Assessment. Cambridge Assessment is the brand name of the University of Cambridge Local Examinations Syndicate (UCLES), which is a department of the University of Cambridge.

© UCLES 2025