Cambridge Assessment International Education

Cambridge IGCSE™

CANDIDATE NAME									
CENTRE NUMBER						CANDIDATE NUMBER				

ADDITIONAL MATHEMATICS **0606/23**

Paper 2 **October/November 2025**

2 hours

You must answer on the question paper.

No additional materials are needed.

INSTRUCTIONS

- Answer **all** questions.
- Use a black or dark blue pen. You may use an HB pencil for any diagrams or graphs.
- Write your name, centre number and candidate number in the boxes at the top of the page.
- Write your answer to each question in the space provided.
- Do **not** use an erasable pen or correction fluid.
- Do **not** write on any bar codes.
- You should use a scientific calculator where appropriate.
- You must show all necessary working clearly.
- Give non-exact numerical answers correct to 3 significant figures, or 1 decimal place for angles in degrees, unless a different level of accuracy is specified in the question.
- For π, use either your calculator value or 3.142.

INFORMATION

- The total mark for this paper is 80.
- The number of marks for each question or part question is shown in brackets [ ].

This document has **16** pages.

© UCLES 2025

List of formulas

Equation of a circle with centre (a, b) and radius r. $(x - a)^2 + (y - b)^2 = r^2$

Curved surface area, A, of cone of radius r, sloping edge l. $A = \pi rl$

Surface area, A, of sphere of radius r. $A = 4\pi r^2$

Volume, V, of pyramid or cone, base area A, height h. $V = \frac{1}{3}Ah$

Volume, V, of sphere of radius r. $V = \frac{4}{3}\pi r^3$

Quadratic equation

For the equation $ax^2 + bx + c = 0$,

$$x = \frac{-b \pm \sqrt{b^2 - 4ac}}{2a}$$

Binomial theorem

$$(a + b)^n = a^n + \binom{n}{1}a^{n-1}b + \binom{n}{2}a^{n-2}b^2 + \ldots + \binom{n}{r}a^{n-r}b^r + \ldots + b^n,$$

where n is a positive integer and $\binom{n}{r} = \frac{n!}{(n-r)!r!}$

Arithmetic series

$$u_n = a + (n - 1)d$$
$$S_n = \frac{1}{2}n(a + l) = \frac{1}{2}n\{2a + (n - 1)d\}$$

Geometric series

$$u_n = ar^{n-1}$$
$$S_n = \frac{a(1 - r^n)}{1 - r} \quad (r \neq 1)$$
$$S_\infty = \frac{a}{1 - r} \quad (|r| < 1)$$

Identities

$$\sin^2 A + \cos^2 A = 1$$
$$\sec^2 A = 1 + \tan^2 A$$
$$\operatorname{cosec}^2 A = 1 + \cot^2 A$$

Formulas for ΔABC

$$\frac{a}{\sin A} = \frac{b}{\sin B} = \frac{c}{\sin C}$$
$$a^2 = b^2 + c^2 - 2bc\cos A$$
$$\Delta = \frac{1}{2}ab\sin C$$

© UCLES 2025

1 It is given that $\mathrm{p}(x) = ax^3 - 7x^2 - bx + 9$, where a and b are constants.
$x - 3$ is a factor of $\mathrm{p}(x)$.
When $\mathrm{p}(x)$ is divided by $x + 2$ the remainder is -35.

View solution

Find the values of a and b. [5]

© UCLES 2025

2 (a) (i)

View solution

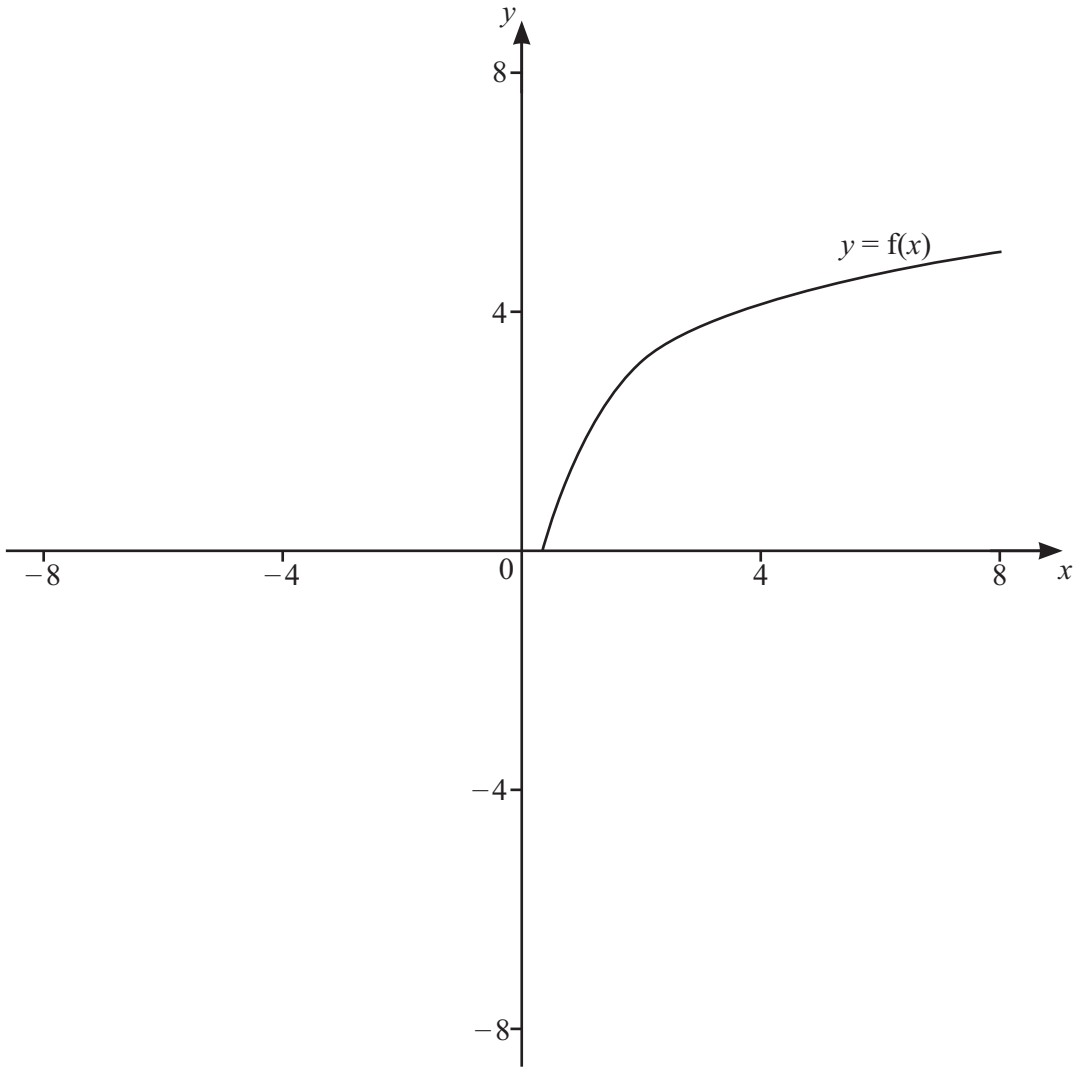

The diagram shows the graph of $y = f(x)$.

On the same diagram sketch the graph of $y = f^{-1}(x)$. [1]

(ii) Describe the relationship between the graph of $f(x)$ and the graph of $f^{-1}(x)$. [1]

View solution

(b) A function g is defined by $\mathrm{g}(x) = \mathrm{e}^{\sqrt{x-2}}$ for $x \geqslant 2$.

(i) Find an expression for $\mathrm{g}^{-1}(x)$. [3]

View solution

(ii) Write down the range of g^{-1}. [1]

View solution

(iii) A function h is defined by $\mathrm{h}(x) = \frac{1}{x^2} + 2$ for $x > 0$.

View solution

Find an expression for $\mathrm{gh}(x)$ in its simplest form. [2]

© UCLES 2025

3 **(a)** **(i)** Write $x^2 - x - 6$ in the form $(x+a)^2 + b$ where a and b are constants. [2]

View solution

(ii) Hence write down the coordinates of the stationary point on the curve $y = x^2 - x - 6$. [2]

View solution

(b) On the axes, draw the graph of $y = |x^2 - x - 6|$ for $-4 \leqslant x \leqslant 4$. [3]

View solution

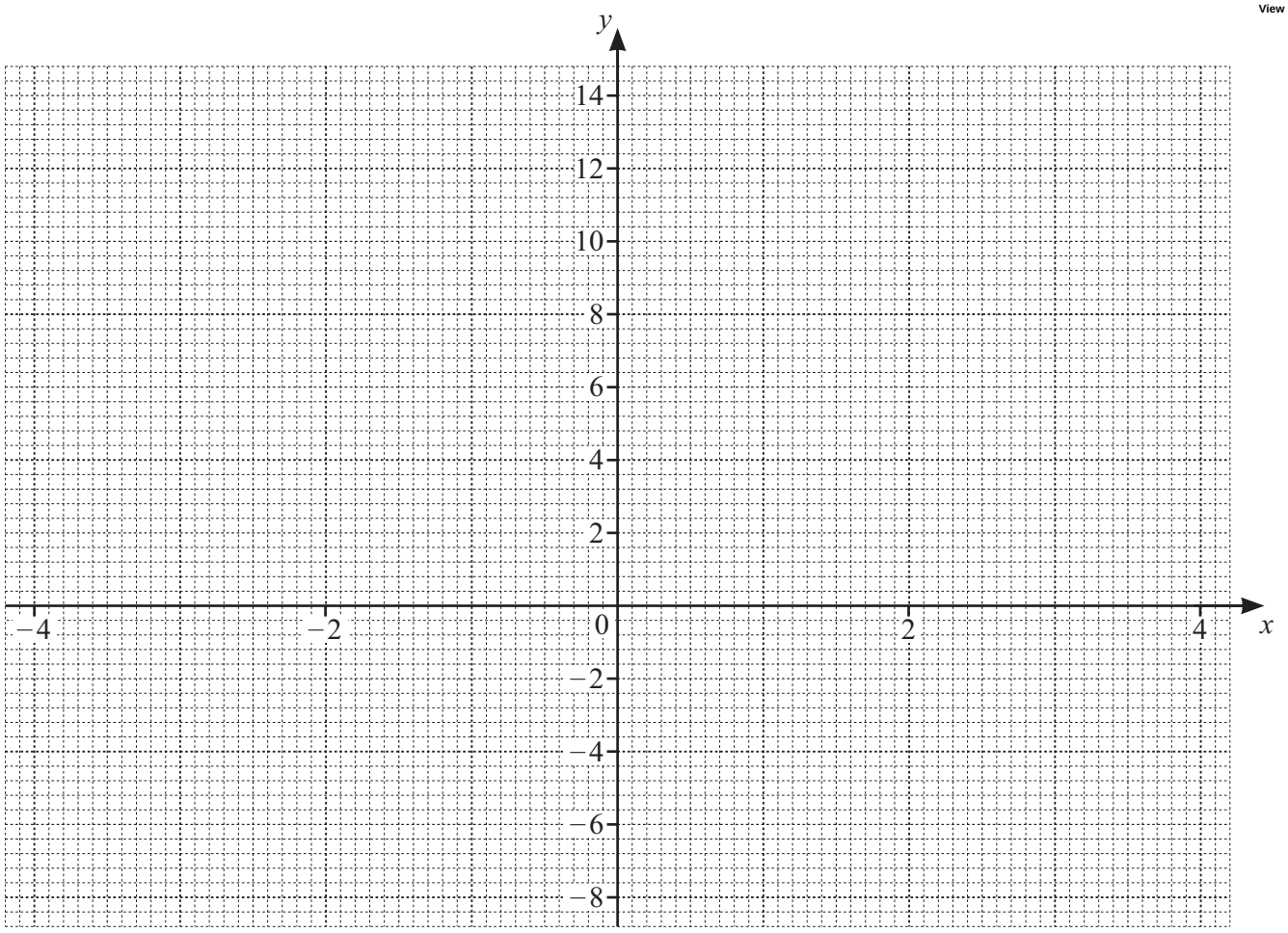

(c) Use your graph to solve the inequality $|x^2 - x - 6| < 4$. [2]

View solution

4 **(a)** Integrate the following with respect to x.

(i) e^{5x-2} [2]

View solution

(ii) $\frac{1}{4-3x}$ where $x < \frac{4}{3}$ [2]

View solution

(b) Show that $\int_{\frac{\pi}{3}}^{\frac{\pi}{2}} \sec^2\left(\frac{1}{2}x\right) dx = 2\left(1 - \frac{\sqrt{3}}{3}\right)$. [3]

View solution

5 Six different digits are chosen from the nine digits 1, 2, 3, 4, 5, 6, 7, 8, 9.
These digits are used to form a 6-digit number.
Find how many 6-digit numbers can be formed in the following cases.

(a) There are no restrictions. [1]

View solution

(b) The number is greater than 700 000. [2]

View solution

(c) The number is greater than 750 000. [3]

View solution

6 The line $y = 3x + 4$ meets the curve $y = 2x^2 + 8x + 1$ at two points A and B.

Find the equation of the perpendicular bisector of AB, giving your answer in the form $ax + by + c = 0$, where a, b and c are integers. [9]

View solution

7 Solve the equation $\sec^2 3x + \tan 3x - 3 = 0$ for $0° \leqslant x \leqslant 120°$. [6]

View solution

8 In this question the units are metres.

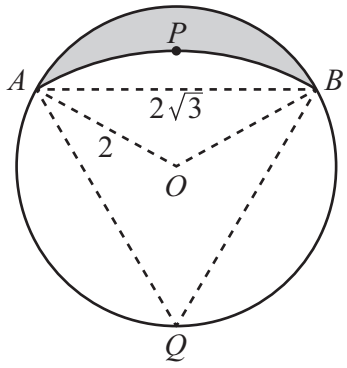

The diagram shows a circle, centre O and radius 2.
The chord AB has length $2\sqrt{3}$.
The point Q lies on the circle such that $AQ = BQ$.
The arc APB is part of a circle, centre Q.

(a) Find the exact value of angle AQB in radians. [2]

View solution

(b) Hence find the area of the shaded region. Give your answer in terms of π. [6]

View solution

9 Two variables, x and y, are related by an equation of the form $y = Ax^b$, where A and b are constants. The following pairs of values of x and y are given.

x	0.61	4.48	12.18	33.1
y	1.65	4.47	7.39	12.17

(a) On the axes below, use these values to draw the straight-line graph of $\ln y$ against $\ln x$. [2]

View solution

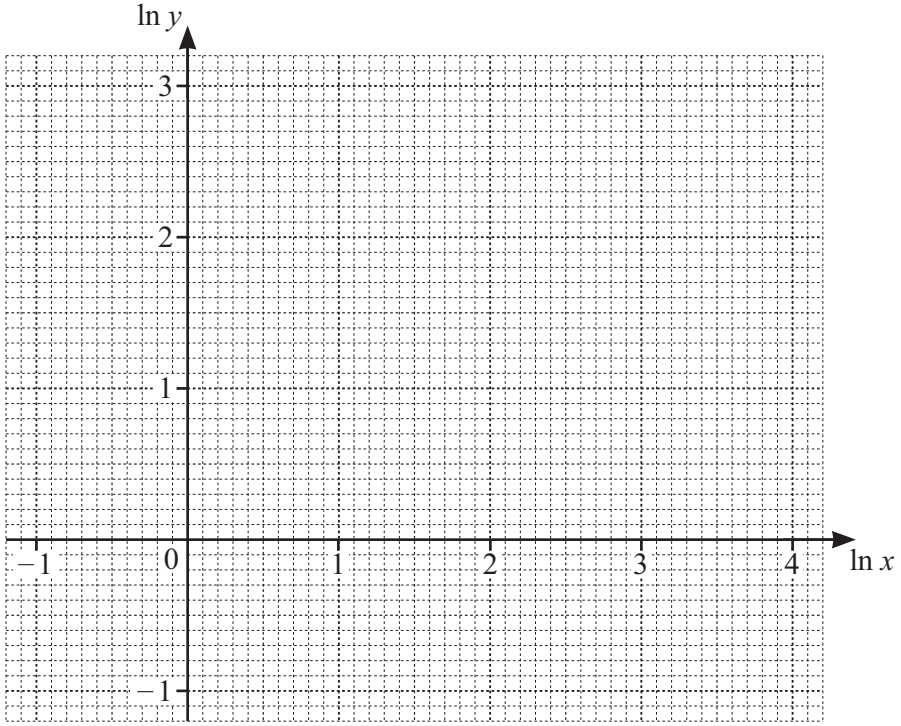

(b) Use your graph to find the values of A and b. [4]

View solution

10 In this question the units are metres and seconds.

A particle moves along a straight line through a point A.

Its displacement, s, from A at time t is given by $s = \dfrac{10t + 100}{\sqrt{2t^2 + 100}}$.

The diagram shows the displacement–time graph for the first 30 seconds of the motion.

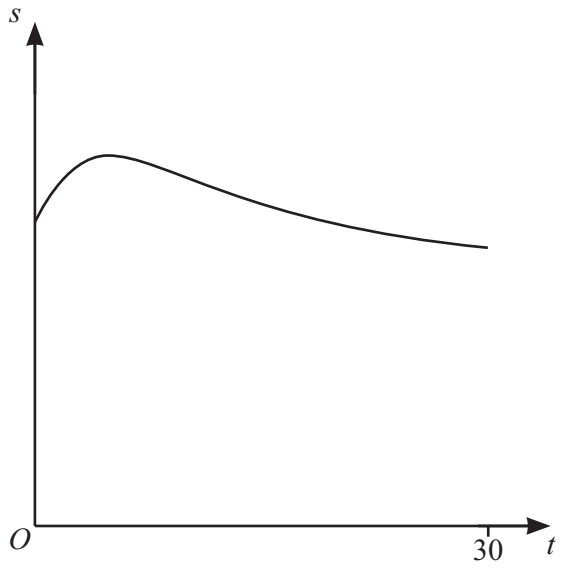

(a) Find the value of t when s is a maximum. [6]

View solution

(b) The particle passes through its starting point again at time $t = T$.

(i) Find the total distance travelled by the particle during the first T seconds of its motion. [2]

View solution

(ii) Use algebra to find T. [3]

View solution

Question 11 is printed on the next page.

11 A circle has equation $x^2 + y^2 - 25 = 0$.
A second circle has the same radius as the first circle, and the coordinates of its centre are both positive.
The two circles intersect at the points A and B.
The line AB has length 6 and is parallel to the line $y = -x$.

Find the equation of the second circle in the form $x^2 + y^2 + ax + by + c = 0$, where a, b and c are constants. [5]


View solution

Permission to reproduce items where third-party owned material protected by copyright is included has been sought and cleared where possible. Every reasonable effort has been made by the publisher (UCLES) to trace copyright holders, but if any items requiring clearance have unwittingly been included, the publisher will be pleased to make amends at the earliest possible opportunity.

To avoid the issue of disclosure of answer-related information to candidates, all copyright acknowledgements are reproduced online in the Cambridge Assessment International Education Copyright Acknowledgements Booklet. This is produced for each series of examinations and is freely available to download at www.cambridgeinternational.org after the live examination series.

Cambridge Assessment International Education is part of Cambridge Assessment. Cambridge Assessment is the brand name of the University of Cambridge Local Examinations Syndicate (UCLES), which is a department of the University of Cambridge.

© UCLES 2025