Cambridge Assessment International Education

Cambridge IGCSE™

BIOLOGY **0610/13**

Paper 1 Multiple Choice (Core) **May/June 2025**

45 minutes

You must answer on the multiple choice answer sheet.

You will need: Multiple choice answer sheet
Soft clean eraser
Soft pencil (type B or HB is recommended)

INSTRUCTIONS

- There are **forty** questions on this paper. Answer **all** questions.
- For each question there are four possible answers **A**, **B**, **C** and **D**. Choose the **one** you consider correct and record your choice in soft pencil on the multiple choice answer sheet.
- Follow the instructions on the multiple choice answer sheet.
- Write in soft pencil.
- Write your name, centre number and candidate number on the multiple choice answer sheet in the spaces provided unless this has been done for you.
- Do **not** use correction fluid.
- Do **not** write on any bar codes.
- You may use a calculator.

INFORMATION

- The total mark for this paper is 40.
- Each correct answer will score one mark.
- Any rough working should be done on this question paper.

IB25 06_0610_13/3RP
© UCLES 2025

1 The Venus flytrap is a plant that feeds on insects. When an insect lands on a specially adapted leaf, the leaf folds very quickly and traps the insect. The leaves produce enzymes which digest the insect.

View solution

Which characteristics of living organisms are involved?

A excretion, growth, nutrition

B movement, excretion, nutrition

C movement, sensitivity, growth

D movement, sensitivity, nutrition

2 A rat has the scientific name *Rattus rattus*.

View solution

What do the two parts of this name refer to?

A genus and species

B kingdom and genus

C kingdom and species

D species and group

3 Which of the animals shown is a crustacean?

View solution

A



B



C

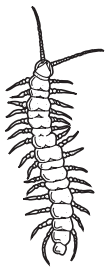

D



4 Which features do animal cells share with plant cells?

View solution

	chloroplast	cytoplasm	nucleus
A	yes	yes	yes
B	yes	yes	no
C	no	yes	yes
D	no	no	yes

© UCLES 2025

5 A student makes a drawing of an animal.

View solution

The length of the animal in the drawing is 30 mm.

The actual length of the animal is 200 mm.

What is the magnification of the student's drawing?

A ×0.15 **B** ×6.67 **C** ×15 **D** ×6000

6 Some pieces of potato plant tissue are placed in a very concentrated sugar solution. Other pieces of potato plant tissue are placed in distilled water.

View solution

What happens to the mass of the potato pieces in the two liquids?

	mass of the potato pieces in a very concentrated sugar solution	mass of the potato pieces in distilled water
A	decreases	decreases
B	decreases	increases
C	increases	decreases
D	increases	increases

7 Which statement describes the net movement of particles by active transport in animal cells?

View solution

A from a higher concentration to a lower concentration across a cell membrane

B from a higher concentration to a lower concentration across a cell wall

C from a lower concentration to a higher concentration across a cell membrane

D from a lower concentration to a higher concentration across a cell wall

8 Which chemical tests should a student use to test lemon juice for reducing sugars and vitamin C?

View solution

	reducing sugars	vitamin C
A	Benedict's solution test	DCPIP solution test
B	Benedict's solution test	ethanol emulsion test
C	biuret test	DCPIP solution test
D	biuret test	ethanol emulsion test

© UCLES 2025

9 Which graph shows the effect of pH on enzyme activity?

View solution

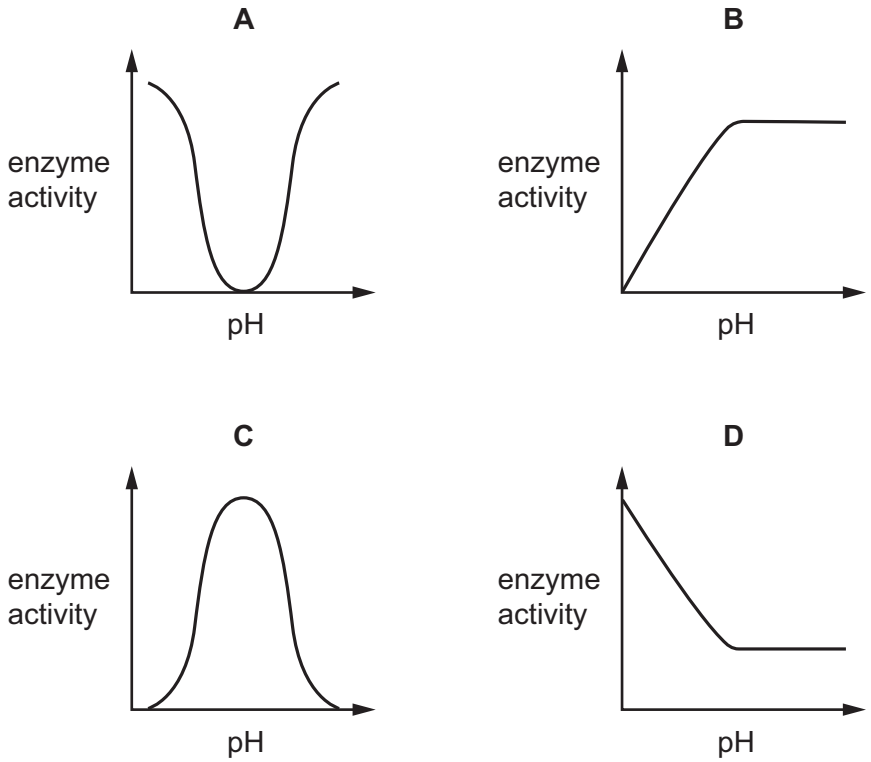

10 The graph shows the effect of temperature on an enzyme-controlled reaction.

View solution

At which point on the graph is the enzyme completely denatured?

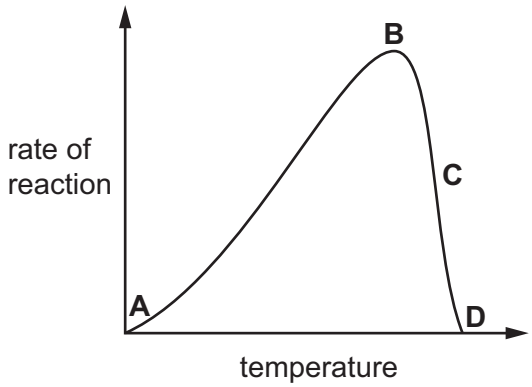

11 Which carbohydrate is used to build plant cell walls?

View solution

A cellulose

B glycogen

C starch

D sucrose

© UCLES 2025

12 In a cross-section of a leaf, what is the correct order of structures moving from the upper surface of the leaf towards the lower surface of the leaf?

View solution

A cuticle, epidermis, palisade mesophyll, spongy mesophyll

B cuticle, epidermis, spongy mesophyll, palisade mesophyll

C epidermis, cuticle, palisade mesophyll, spongy mesophyll

D epidermis, cuticle, spongy mesophyll, palisade mesophyll

13 What is the result of a diet lacking iron?

View solution

A bleeding gums

B poor wound healing

C reduced number of red blood cells

D weak bones and teeth

14 The diagram shows part of the human digestive system.

View solution

Where is lipase made?

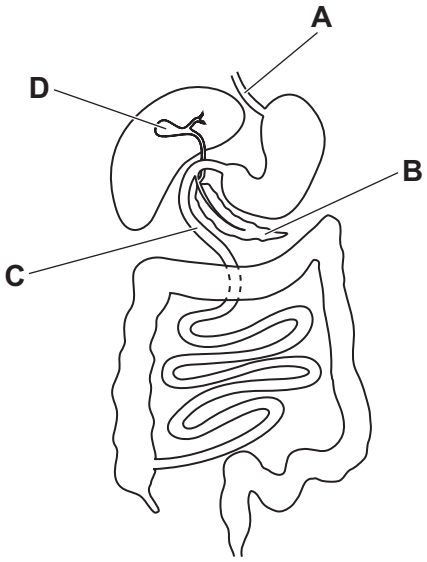

15 Which row about an enzyme in the alimentary canal is correct?

View solution

	site of action	enzyme	substrate
A	mouth	amylase	protein
B	mouth	protease	starch
C	stomach	protease	protein
D	stomach	amylase	starch

© UCLES 2025

16 What is the pathway taken by water through a plant?

View solution

A root cortex cells → root hair cells → mesophyll cells → xylem

B root cortex cells → root hair cells → xylem → mesophyll cells

C root hair cells → root cortex cells → mesophyll cells → xylem

D root hair cells → root cortex cells → xylem → mesophyll cells

17 Which blood vessel transports blood away from the kidney?

View solution

A pulmonary artery

B pulmonary vein

C renal artery

D renal vein

18 The diagram shows part of the gas exchange system in humans.

View solution

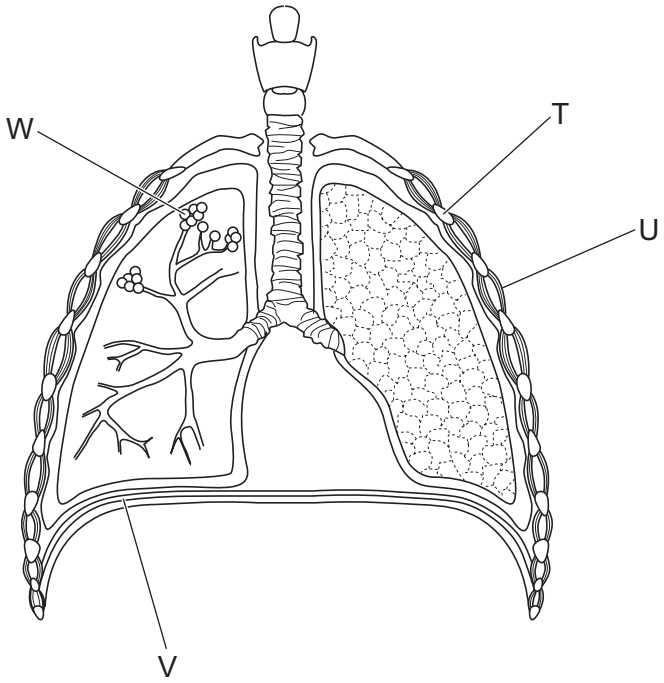

Which row identifies the structures in the diagram?

	T	U	V	W
A	rib	intercostal muscle	diaphragm	alveoli
B	intercostal muscle	rib	alveoli	diaphragm
C	rib	intercostal muscle	alveoli	diaphragm
D	intercostal muscle	rib	diaphragm	alveoli

© UCLES 2025

19 Which structure is the site of aerobic respiration in plant cells?

View solution

A chloroplast

B mitochondrion

C nucleus

D ribosome

20 Which substance is a product of anaerobic respiration in human muscles?

View solution

A alcohol

B carbon dioxide

C glucose

D lactic acid

21 The diagram shows a human organ system.

View solution

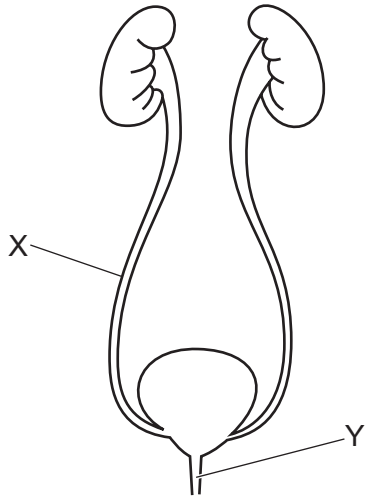

What are the names of structures X and Y?

	X	Y
A	renal artery	renal vein
B	renal vein	renal artery
C	ureter	urethra
D	urethra	ureter

22 The diagram shows a section through the human eye.

View solution

Which label identifies the iris?

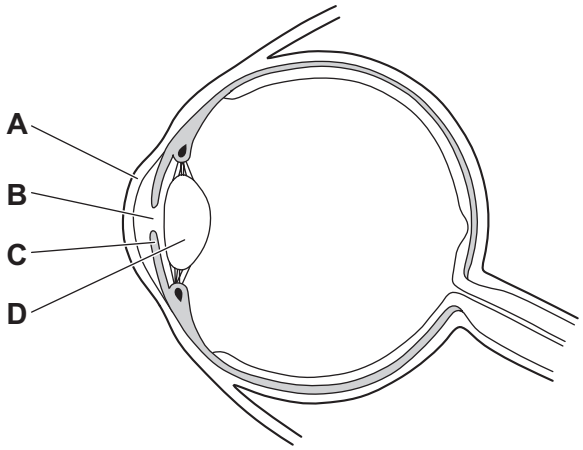

23 Which hormone decreases blood glucose concentration?

View solution

A adrenaline

B glycogen

C insulin

D oestrogen

24 What is the result of asexual reproduction?

View solution

A genetically different offspring from one parent

B genetically different offspring from two parents

C genetically identical offspring from one parent

D genetically identical offspring from two parents

© UCLES 2025

25 Four test-tubes are set up as shown and placed in the dark.

View solution

In which test-tube will the seeds germinate first?

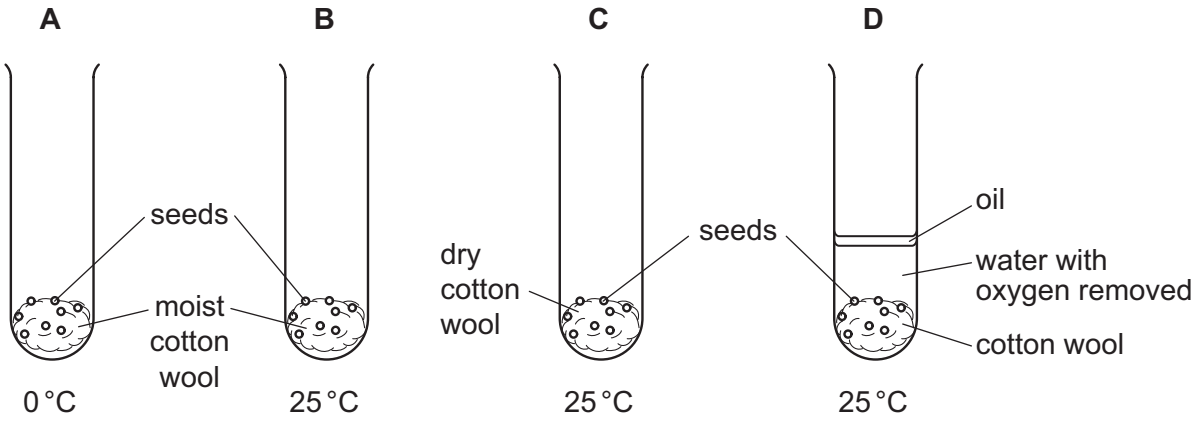

26 Where in the human male reproductive system are sperm produced?

View solution

A penis

B prostate gland

C scrotum

D testes

27 A person's menstrual cycle lasts for 28 days.

View solution

Which statement describes an event in this menstrual cycle?

A The ovary releases an egg on day 14.

B The ovary releases an egg on day 21.

C The uterus lining breaks down on days 14 to 21.

D The uterus lining builds up on days 1 to 7.

28 An individual has the genotype Bb.

View solution

What is the correct description of this genotype?

A heterozygous, with two different alleles of the same gene

B heterozygous, with two different genes of the same allele

C homozygous, with two different alleles of the same gene

D homozygous, with two different genes of the same allele

© UCLES 2025

29 Which statement describes inheritance?

View solution

A organisms which are **not** pure-breeding

B the difference between homozygous and heterozygous genotypes

C the genetic information in dominant alleles

D the transmission of genetic information from generation to generation

30 What is a feature of natural selection?

View solution

A genetic variation within populations

B plenty of resources

C production of genetically identical offspring

D selection by humans

31 What is the principal source of energy input to biological systems?

View solution

A carbon dioxide in air

B glucose

C minerals in soil

D the Sun

© UCLES 2025

32 The diagram shows a food web.

View solution

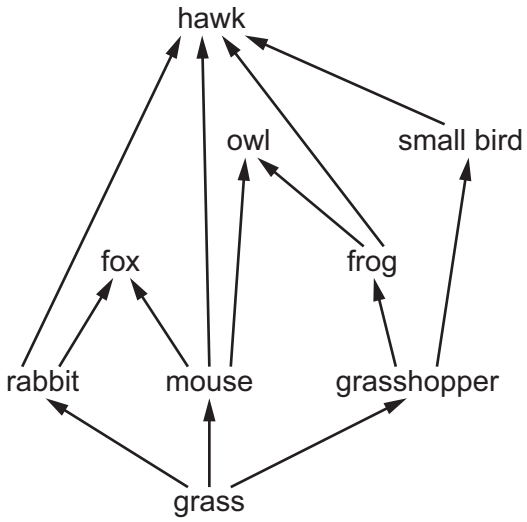

Which food chain is part of the food web?

A grass → frog → owl → hawk

B grass → grasshopper → frog → hawk

C grass → grasshopper → mouse → fox

D grass → rabbit → owl → fox

33 The diagram shows part of the carbon cycle.

View solution

Which process produces carbon dioxide from substances made by photosynthesis millions of years ago?

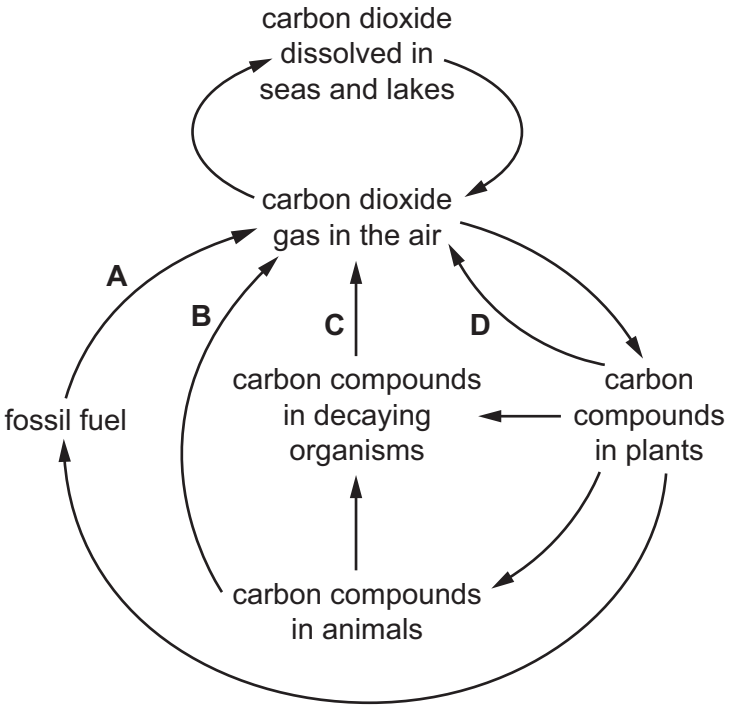

34 The diagram shows a graph of population growth.

On which part of the graph is the population size limited by the amounts of resources available?

View solution

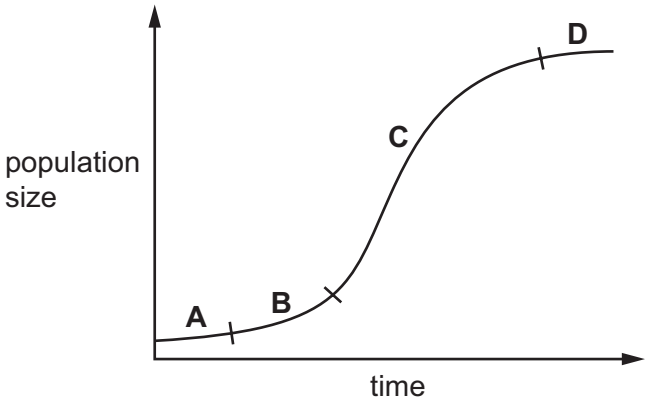

35 Two methods of livestock production are described.

View solution

method 1 Animals are kept in a small area and their movement is restricted.

method 2 Animals are allowed to move freely around a large area.

What is an **advantage** of method 1 compared with method 2?

A increased pollution

B increased consumption of food by animals

C increased rate of spread of infectious disease

D increased yield of animal product

36 Some species of aquatic insects are able to survive at different ranges of pH.

View solution

The diagram shows the pH ranges in which four different species are able to survive.

Which species is **unable** to live in an acidic environment?

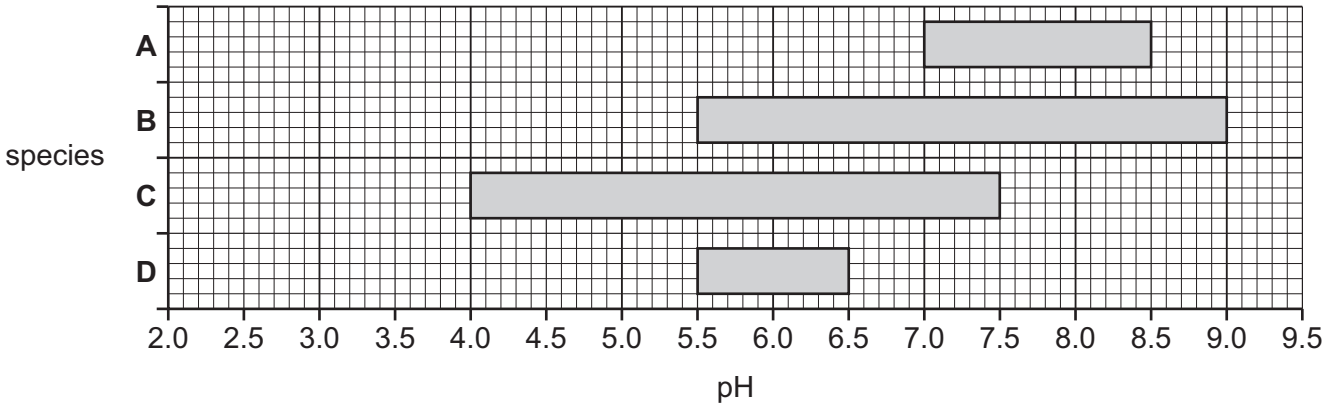

37 Which practice helps to maintain biodiversity?

View solution

A improving crop yields by using herbicides

B increasing crop yields by using insecticides

C the protection of habitats

D the use of large-scale monocultures

38 The diagram shows four positions on a river where water samples were taken.

View solution

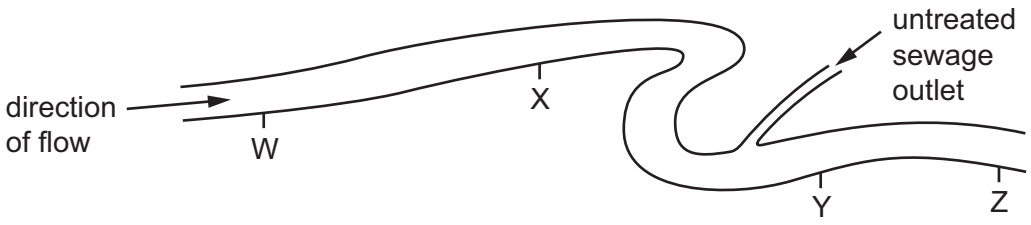

Which graph shows oxygen concentrations in the river?

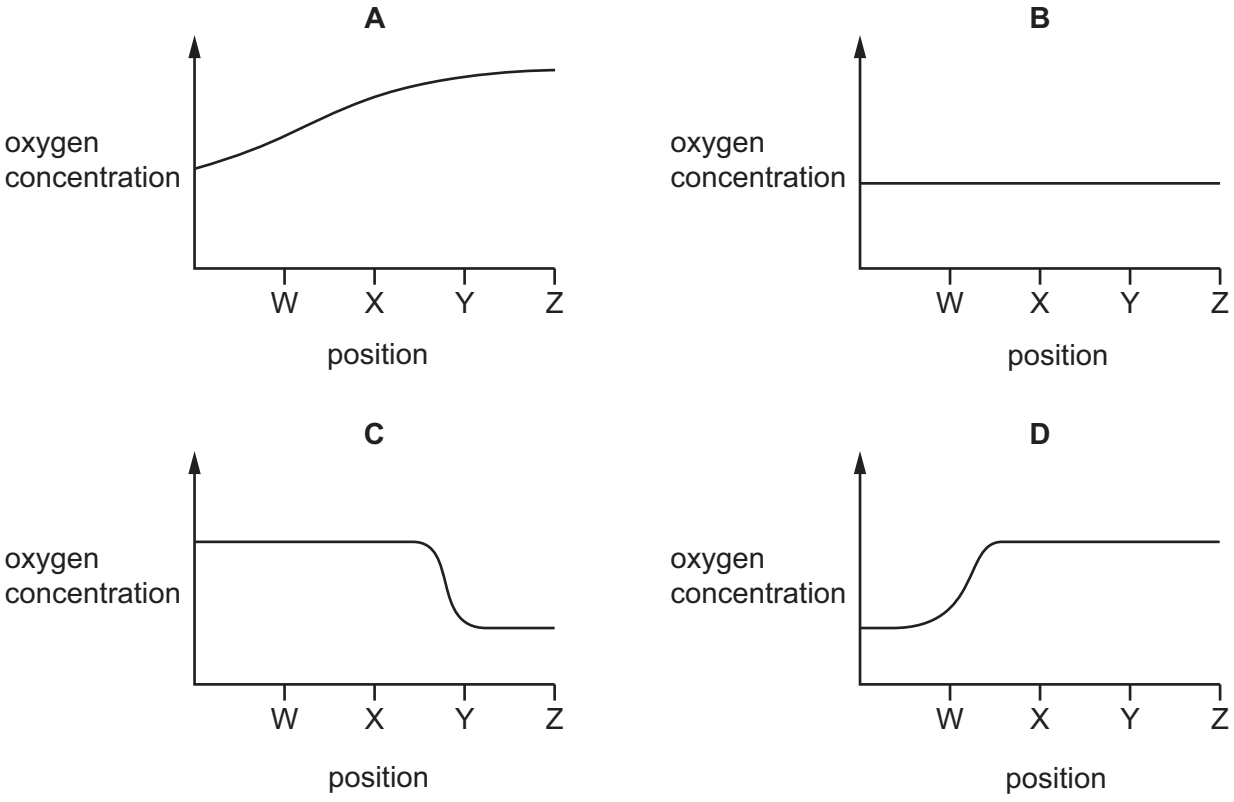

39 Which feature makes bacteria useful in genetic modification?

View solution

A can make complex molecules

B have a cell membrane

C have a cell wall

D reproduce slowly

© UCLES 2025

40 Scientists have developed a genetically modified pineapple plant that produces pink fruit.

The pineapple fruit is pink because of increased concentrations of a substance called lycopene. Eating foods containing lycopene may have health benefits for humans.

View solution

Which statement describes the purpose of this genetic modification?

A to confer resistance to insect pests

B to confer resistance to herbicides

C to improve the nutritional qualities

D to improve the crop yield

© UCLES 2025

BLANK PAGE

BLANK PAGE

Permission to reproduce items where third-party owned material protected by copyright is included has been sought and cleared where possible. Every reasonable effort has been made by the publisher (UCLES) to trace copyright holders, but if any items requiring clearance have unwittingly been included, the publisher will be pleased to make amends at the earliest possible opportunity.

To avoid the issue of disclosure of answer-related information to candidates, all copyright acknowledgements are reproduced online in the Cambridge Assessment International Education Copyright Acknowledgements Booklet. This is produced for each series of examinations and is freely available to download at www.cambridgeinternational.org after the live examination series.

Cambridge Assessment International Education is part of Cambridge Assessment. Cambridge Assessment is the brand name of the University of Cambridge Local Examinations Syndicate (UCLES), which is a department of the University of Cambridge.

© UCLES 2025