Cambridge Assessment International Education

Cambridge IGCSE™

BIOLOGY **0610/11**

Paper 1 Multiple Choice (Core) **October/November 2025**

45 minutes

You must answer on the multiple choice answer sheet.

You will need: Multiple choice answer sheet
Soft clean eraser
Soft pencil (type B or HB is recommended)

INSTRUCTIONS

- There are **forty** questions on this paper. Answer **all** questions.
- For each question there are four possible answers **A**, **B**, **C** and **D**. Choose the **one** you consider correct and record your choice in soft pencil on the multiple choice answer sheet.
- Follow the instructions on the multiple choice answer sheet.
- Write in soft pencil.
- Write your name, centre number and candidate number on the multiple choice answer sheet in the spaces provided unless this has been done for you.
- Do **not** use correction fluid.
- Do **not** write on any bar codes.
- You may use a calculator.

INFORMATION

- The total mark for this paper is 40.
- Each correct answer will score one mark.
- Any rough working should be done on this question paper.

IB25 11_0610_11/6RP
© UCLES 2025

1 Which three characteristics apply to all organisms?

View solution

A egestion, movement and photosynthesis

B egestion, movement and respiration

C excretion, movement and respiration

D excretion, photosynthesis and respiration

2 The song thrush, *Turdus philomelos*, is a bird.

View solution

What is the genus of this bird?

A *philomelos*

B song

C thrush

D *Turdus*

3 How many pairs of jointed legs does an arachnid have?

View solution

A two pairs only

B three pairs only

C four pairs only

D more than four pairs

4 Which structure is found in bacterial cytoplasm but **not** in the cytoplasm of animal cells?

View solution

A cell membrane

B cell wall

C nucleus

D plasmid

5 Which row correctly matches a type of specialised cell with its function?

View solution

	type of cell	function
A	ciliated cell	absorption of nutrients
B	palisade mesophyll cell	production of starch
C	root cortex cell	absorption of mineral ions from the soil
D	white blood cell	transport of oxygen

© UCLES 2025

6 Different factors affect the rate of diffusion of molecules across a membrane.

View solution

Which row shows the changes that will result in the greatest increase in the rate of diffusion?

	concentration gradient across a membrane	thickness of the membrane	surface area of the membrane	temperature
A	decrease	decrease	decrease	increase
B	decrease	increase	increase	decrease
C	increase	decrease	increase	increase
D	increase	increase	decrease	decrease

7 The diagram shows part of a cross-section of a leaf.

View solution

Which arrow shows the movement of water by osmosis in the leaf?

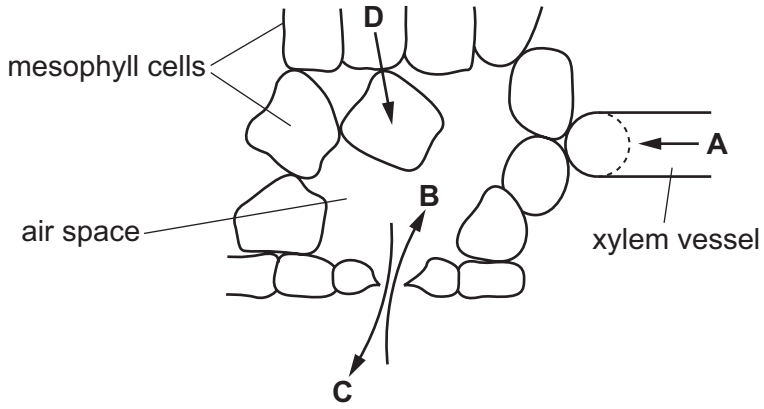

8 The table shows the results of some food tests.

View solution

Which row shows a food that contains carbohydrates only?

	Benedict's solution test	biuret test	ethanol emulsion test	iodine solution test
A	blue	purple	clear	blue-black
B	blue	blue	cloudy	yellow-brown
C	red	blue	clear	blue-black
D	red	purple	cloudy	yellow-brown

© UCLES 2025

9 What catalyses the chemical reactions needed to sustain life in organisms?

View solution

A enzymes

B hormones

C mitochondria

D ribosomes

10 Which process in plant cells requires chlorophyll?

View solution

A fertilisation

B nutrition

C movement

D respiration

11 Which molecule contains nitrogen?

View solution

A fat

B glucose

C protein

D starch

© UCLES 2025

12 The diagram shows part of a cross-section of a leaf.

View solution

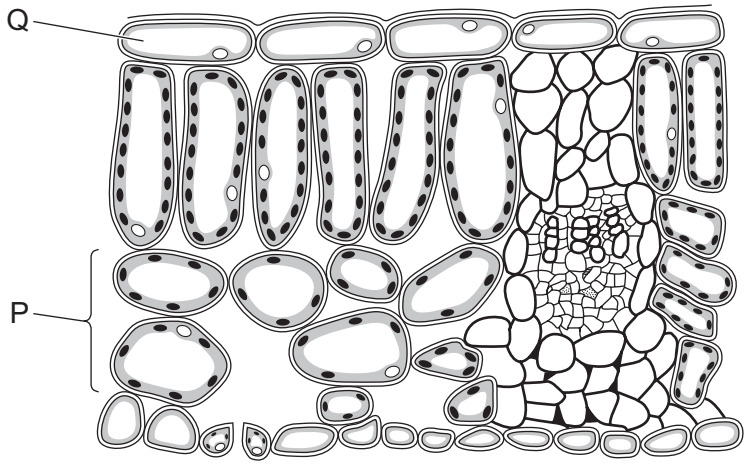

Which row correctly identifies tissue P and the tissue that contains cell Q?

	P	Q
A	palisade mesophyll	cuticle
B	palisade mesophyll	upper epidermis
C	spongy mesophyll	cuticle
D	spongy mesophyll	upper epidermis

13 Which nutrients in the diet prevent rickets?

View solution

A calcium and vitamin C

B calcium and vitamin D

C iron and vitamin C

D iron and vitamin D

© UCLES 2025

14 The diagram shows part of the human digestive system.

View solution

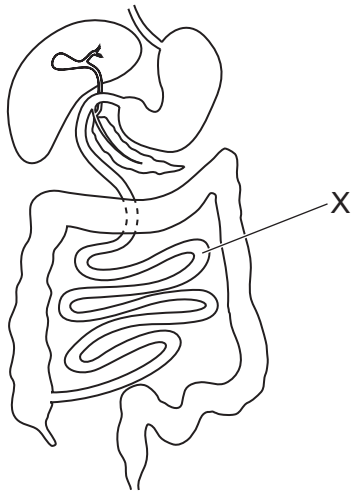

What is a function of the part labelled X?

A absorption

B egestion

C excretion

D ingestion

15 What increases the surface area of food for the action of enzymes?

View solution

A absorption

B active transport

C respiration

D physical digestion

16 The graph shows the effect of pH on the activity of an enzyme.

View solution

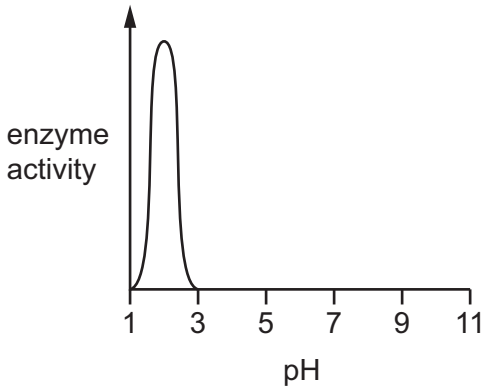

In which part of the alimentary canal would this enzyme be **most** active?

A large intestine

B mouth

C small intestine

D stomach

17 Which processes occur during transpiration?

View solution

1 Water diffuses from the air spaces into the mesophyll cells.

2 Water evaporates from surfaces of mesophyll cells into air spaces.

3 Water from air spaces evaporates through stomata.

4 Water vapour from air spaces diffuses through stomata.

A 1 and 3 **B** 1 and 4 **C** 2 and 3 **D** 2 and 4

18 What is the sequence in which blood flows through the circulatory system?

View solution

A arteries → veins → capillaries → heart

B capillaries → arteries → heart → veins

C capillaries → veins → heart → arteries

D heart → veins → arteries → capillaries

© UCLES 2025

19 Which row identifies methods that will reduce the spread of disease?

View solution

	treating sewage	washing hands regularly	providing clean drinking water
A	✓	✓	✓
B	✓	✓	✗
C	✓	✗	✓
D	✗	✓	✓

key

✓ = a method that will reduce the spread of disease

✗ = a method that will **not** reduce the spread of disease

20 Which chemical can be used to show the presence of carbon dioxide?

View solution

A Benedict's solution

B biuret reagent

C DCPIP

D limewater

21 A mixture of glucose, yeast and water was placed in a test-tube. A balloon was attached to the open end of the test-tube. The apparatus was kept at 30 °C for one hour.

View solution

The diagram shows the apparatus.

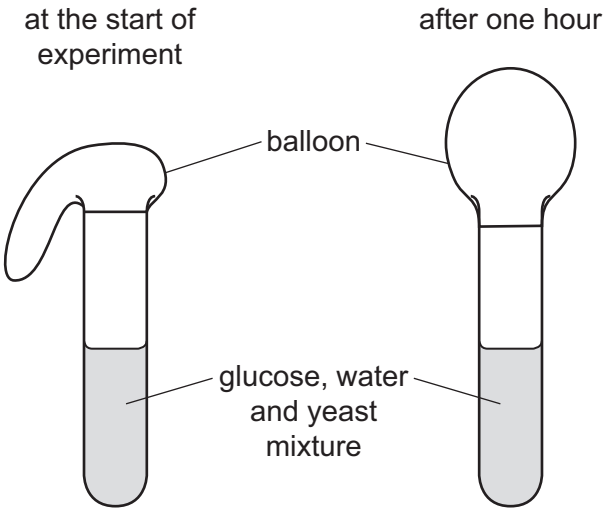

Which word equation can be used to explain what happened to the balloon after one hour?

A carbon dioxide + water → glucose + oxygen

B glucose → alcohol + carbon dioxide

C glucose → carbon dioxide + water

D glucose → lactic acid

22 Urine is formed from the substances excreted by the kidneys. The pie chart shows the composition of urine in a healthy person.

View solution

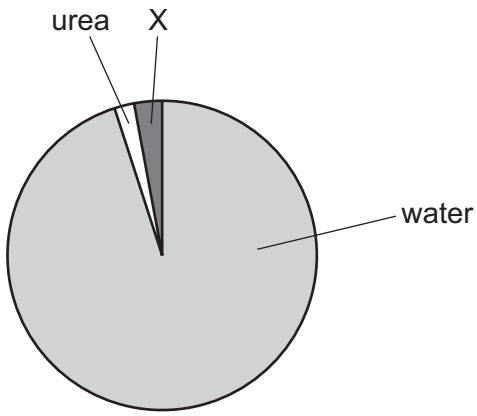

What is label X?

A ions

B platelets

C starch

D sucrose

© UCLES 2025

23 Which hormone increases pupil diameter and is secreted in 'fight or flight' situations?

View solution

A adrenaline

B insulin

C oestrogen

D testosterone

24 Which responses are usually shown by the root of a plant?

View solution

	gravitropism	phototropism
A	–	–
B	–	+
C	+	–
D	+	+

key

+ = grows towards the stimulus

– = grows away from the stimulus

25 The diagram shows a potato tuber that developed from the stem of a parent potato plant. Three shoots are starting to grow from the tuber.

View solution

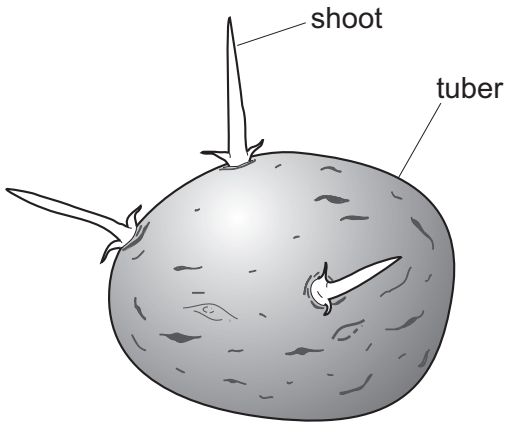

How do the genotypes of the shoots compare with the genotypes of the tuber and of the parent?

	genotype of tuber	genotype of parent
A	is different to the shoots	is different to the shoots
B	is different to the shoots	is identical to the shoots
C	is identical to the shoots	is different to the shoots
D	is identical to the shoots	is identical to the shoots

© UCLES 2025

26 What is a feature of wind-pollinated flowers?

View solution

A anthers inside the flower

B large, brightly coloured petals

C long, feathery stigmas

D production of nectar

27 Which parts of the gametes fuse during fertilisation?

View solution

A cell membranes

B cell walls

C cytoplasm

D nuclei

28 The statements are about some hormones in the human body.

View solution

V promotes the development of breast tissue.

W promotes the development of stronger muscles.

X causes the voice to deepen at puberty.

Y is produced by the pancreas.

Which statements are correct for testosterone?

A V and W **B** V and Y **C** W and X **D** X and Y

29 Which type of organism causes an infection that may lead to AIDS?

View solution

A amphibian

B bacterium

C myriapod

D virus

30 What does a gene code for?

View solution

A an amino acid

B a carbohydrate

C a fat

D a protein

© UCLES 2025

31 Which row shows the sex chromosomes present in human body cells?

View solution

	sex	sex chromosomes present
A	female	XX
B	female	XY
C	male	XX
D	male	YY

32 An individual who is homozygous dominant for a characteristic has the genotype TT. Another individual is heterozygous for this characteristic.

What is the correct percentage of genotypes for the offspring resulting from a genetic cross between these two individuals?

View solution

A 100% Tt

B 50% TT, 50% tt

C 50% TT, 50%Tt

D 25%TT, 50% Tt, 25% tt

33 The graph shows the number of students with each blood group in a class.

View solution

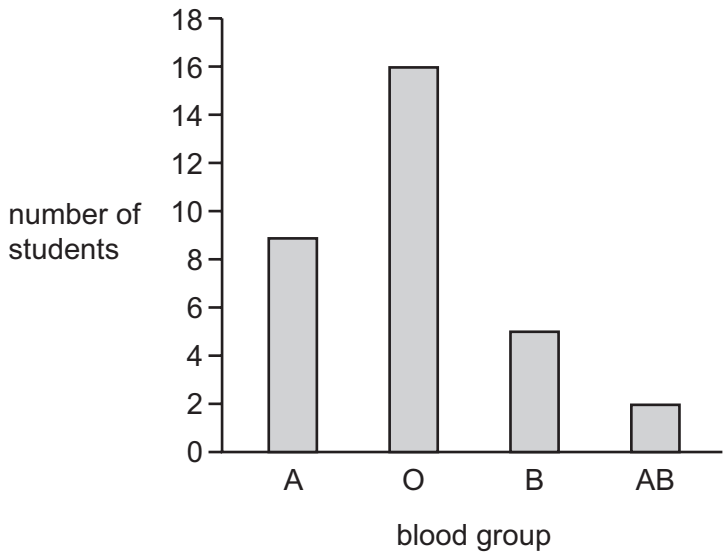

What can be concluded about blood groups from the graph?

A Blood groups are an example of continuous variation caused by genes and the environment.

B Blood groups are an example of continuous variation caused by genes only.

C Blood groups are an example of discontinuous variation caused by genes and the environment.

D Blood groups are an example of discontinuous variation caused by genes only.

34 The diagram shows part of a food web in a pile of dead leaves.

View solution

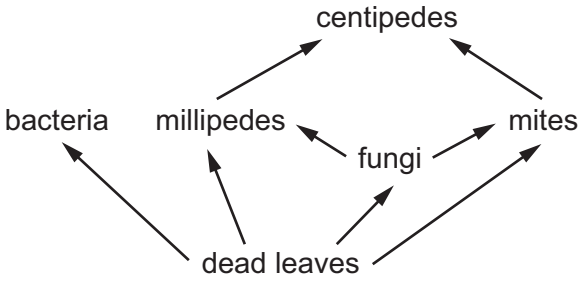

Which row describes the organisms?

	bacteria	centipedes	leaves
A	consumers	herbivores	producers
B	decomposers	carnivores	decomposers
C	decomposers	consumers	producers
D	producers	carnivores	producers

35 The diagram shows an ecological pyramid.

View solution

Which letter represents the producers?

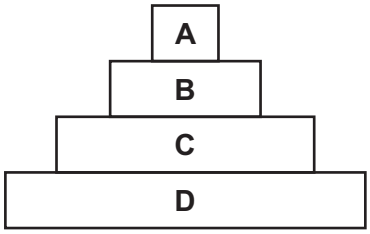

36 The diagrams show the movement of two gases during the day and during the night.

View solution



Which letters represent carbon dioxide?

A W and Y **B** W and Z **C** X and Y **D** X and Z

37 The graph shows the estimated growth of the human population.

View solution

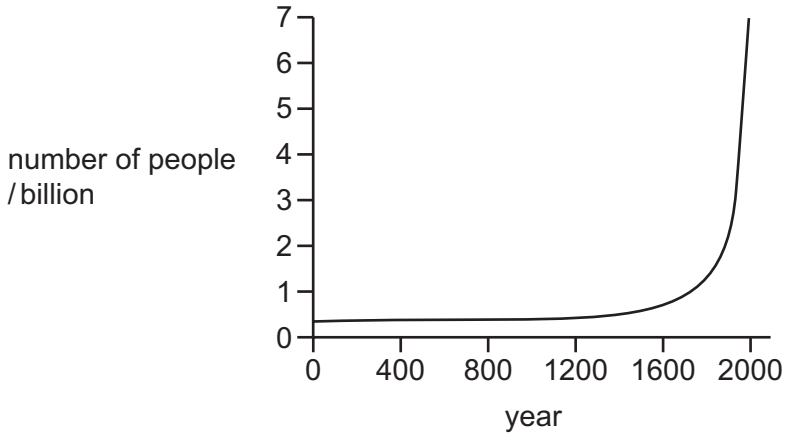

Which phase of population growth is occurring between the years 1600 and 2000?

A death phase

B exponential (log) phase

C lag phase

D stationary phase

38 Which statement describes a sustainable resource?

View solution

A a resource that does **not** require conserving

B a resource that is produced as rapidly as it is removed from the environment

C a resource that is produced using genetic modification

D a resource that results in habitat destruction when extracted from the environment

39 What increases the chance of conserving endangered species?

View solution

A climate change

B education

C hunting

D introducing new species

© UCLES 2025

40 Four statements about genetic modification in crop plants are listed.

View solution

1 They can reduce the amount of herbicide used.

2 They can reduce the amount of insecticide used.

3 They can reduce the damage by pests to crop plants.

4 They can reduce the nutritional quality of crop plants.

Which statements give reasons why genetic modification is used in crop production?

A 1, 2 and 3 **B** 1, 2 and 4 **C** 1, 3 and 4 **D** 2, 3 and 4

© UCLES 2025

BLANK PAGE

Permission to reproduce items where third-party owned material protected by copyright is included has been sought and cleared where possible. Every reasonable effort has been made by the publisher (UCLES) to trace copyright holders, but if any items requiring clearance have unwittingly been included, the publisher will be pleased to make amends at the earliest possible opportunity.

To avoid the issue of disclosure of answer-related information to candidates, all copyright acknowledgements are reproduced online in the Cambridge Assessment International Education Copyright Acknowledgements Booklet. This is produced for each series of examinations and is freely available to download at www.cambridgeinternational.org after the live examination series.

Cambridge Assessment International Education is part of Cambridge Assessment. Cambridge Assessment is the brand name of the University of Cambridge Local Examinations Syndicate (UCLES), which is a department of the University of Cambridge.

© UCLES 2025