Cambridge Assessment International Education

Cambridge IGCSE™

BIOLOGY **0610/12**

Paper 1 Multiple Choice (Core) **October/November 2025**

45 minutes

You must answer on the multiple choice answer sheet.

You will need: Multiple choice answer sheet
Soft clean eraser
Soft pencil (type B or HB is recommended)

INSTRUCTIONS

- There are **forty** questions on this paper. Answer **all** questions.
- For each question there are four possible answers **A**, **B**, **C** and **D**. Choose the **one** you consider correct and record your choice in soft pencil on the multiple choice answer sheet.
- Follow the instructions on the multiple choice answer sheet.
- Write in soft pencil.
- Write your name, centre number and candidate number on the multiple choice answer sheet in the spaces provided unless this has been done for you.
- Do **not** use correction fluid.
- Do **not** write on any bar codes.
- You may use a calculator.

INFORMATION

- The total mark for this paper is 40.
- Each correct answer will score one mark.
- Any rough working should be done on this question paper.

IB25 11_0610_12/5RP
© UCLES 2025

1 Which process causes a permanent increase in the dry mass of an organism?

View solution

A digestion

B growth

C reproduction

D respiration

2 The scientific names of some plants are listed.

View solution

1 *Escallonia resinosa*

2 *Ilex glabra*

3 *Pinus glabra*

4 *Pinus resinosa*

5 *Quercus ilex*

Which plants belong to the same genus?

A 1 and 4 **B** 2 and 3 **C** 2 and 5 **D** 3 and 4

3 An organism has a body with three parts, three pairs of jointed legs and one pair of antennae.

View solution

To which group does the organism belong?

A arachnids

B crustaceans

C insects

D myriapods

4 Which term describes a leaf?

View solution

A cell

B organ

C organism

D tissue

5 The length of an insect in a diagram is 150 mm.

View solution

The magnification of the diagram is ×20.

What is the actual length of the insect?

A 0.13 mm **B** 3.0 mm **C** 7.5 mm **D** 130 mm

© UCLES 2025

6 What are features of osmosis?

View solution

	diffusion is involved	requires a cell wall	requires a partially permeable membrane
A	yes	no	yes
B	yes	no	no
C	no	yes	yes
D	no	yes	no

7 Enzymes are large molecules.

View solution

Which small molecules are they made from?

A amino acids

B carbon dioxide and water

C fatty acids

D sugars

8 Why does the active site of an enzyme fit with its substrate?

View solution

A They denature at the same temperature.

B They have complementary shapes to each other.

C They have the same amount of kinetic energy.

D They have the same shape as each other.

9 Which processes in plants transfer energy from light into energy in chemicals?

View solution

	photosynthesis	respiration
A	yes	yes
B	yes	no
C	no	yes
D	no	no

© UCLES 2025

10 The diagram shows a cross-section of a molar tooth.

View solution

Which letter identifies the dentine?

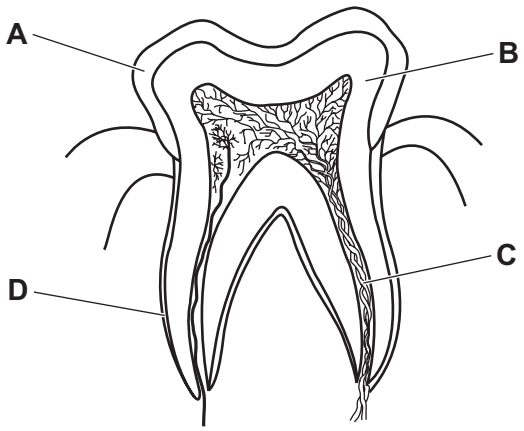

11 The graphs show the effect of pH on the activity of four different digestive enzymes.

View solution

Which enzyme is most active in the stomach?

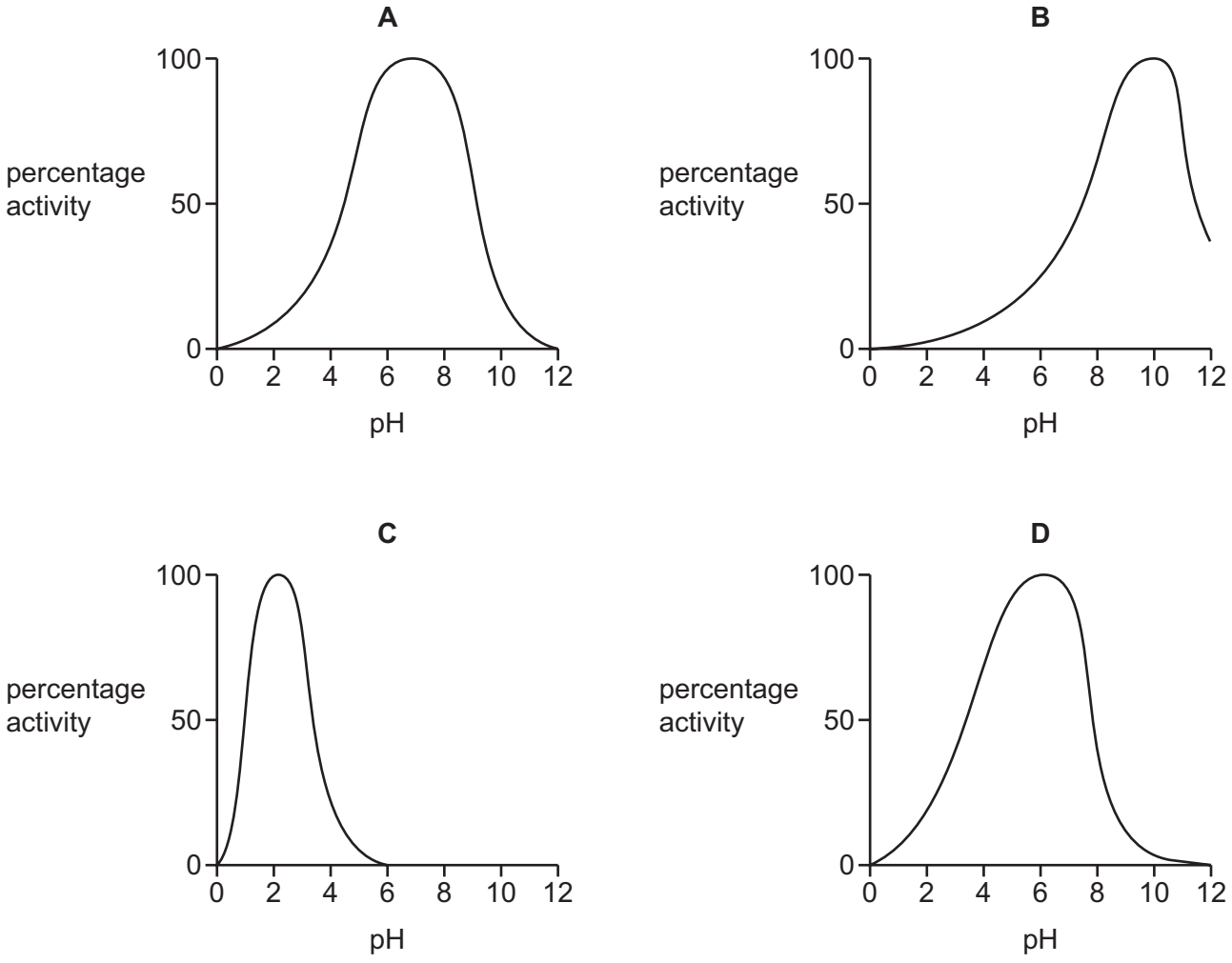

12 In which organ does physical digestion and chemical digestion occur?

View solution

A gall bladder

B liver

C pancreas

D stomach

13 Which pathway is taken by water from the roots to the leaves?

View solution

A root cortex cells → root hair cells → mesophyll cells → xylem

B root cortex cells → root hair cells → xylem → mesophyll cells

C root hair cells → root cortex cells → mesophyll cells → xylem

D root hair cells → root cortex cells → xylem → mesophyll cells

14 What is a function of red blood cells?

View solution

A production of antibodies

B transport of glucose

C transport of hormones

D transport of oxygen

15 Which term can be used to describe all disease-causing organisms?

View solution

A bacteria

B decomposers

C pathogens

D viruses

16 Which row shows how the composition of expired air differs from inspired air?

View solution

	carbon dioxide concentration	oxygen concentration
A	higher	higher
B	higher	lower
C	lower	higher
D	lower	lower

© UCLES 2025

17 Which substance is produced in human muscles during anaerobic respiration?

View solution

A alcohol

B carbon dioxide

C lactic acid

D urea

18 In humans, a ureter and a urethra are two structures involved in excretion.

View solution

Which comparison between a ureter and a urethra is correct?

A Only fluid passing through a ureter contains excess mineral ions and water.

B Only fluid passing through a urethra contains urea.

C Only a ureter is directly attached to the bladder.

D Only a ureter is directly attached to the kidney.

19 The diagram shows the pathway of a reflex arc.

View solution

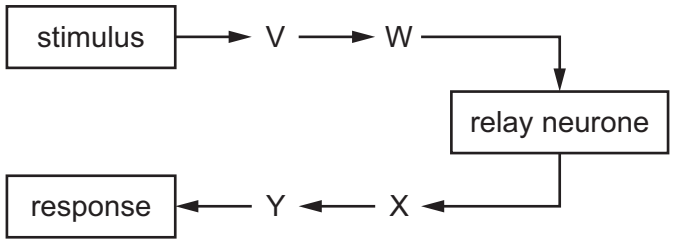

Which row identifies the parts of the reflex arc?

	V	W	X	Y
A	effector	motor neurone	sensory neurone	receptor
B	effector	sensory neurone	motor neurone	receptor
C	receptor	motor neurone	sensory neurone	effector
D	receptor	sensory neurone	motor neurone	effector

20 A person is being chased. This causes a hormone to be released.

View solution

Which row shows how this hormone affects the breathing rate, heart rate and pupil diameter?

	breathing rate	heart rate	pupil diameter
A	increases	increases	increases
B	increases	decreases	decreases
C	decreases	increases	increases
D	decreases	decreases	decreases

© UCLES 2025

21 A plant is placed on the floor in a room, near a window that lets in a lot of light.

View solution

The shoot of the plant grows towards the window.



What could explain this response?

1 growth away from gravity

2 growth towards gravity

3 growth away from the light source

4 growth towards the light source

A 1 and 3 **B** 1 and 4 **C** 2 and 3 **D** 2 and 4

22 A person measures their reaction time five times before and after drinking a cup of coffee. The table shows the results.

View solution

	reaction time / s				
before drinking coffee	0.25	0.30	0.20	0.35	0.15
after drinking coffee	0.20	0.15	0.10	0.20	0.10

Which statement describes the results?

A The mean reaction time after drinking coffee is 0.25 s.

B The mean reaction time before drinking coffee is longer than after drinking coffee.

C The mean reaction time before drinking coffee is 0.15 s.

D The mean reaction time is **not** affected by drinking coffee.

© UCLES 2025

23 Which set of conditions do most seeds require for germination?

View solution

	oxygen	warmth	water
A	✓	✗	✓
B	✓	✓	✗
C	✗	✓	✓
D	✓	✓	✓

key
✓ = required
✗ = **not** required

View solution

24 The diagram shows part of a flower.

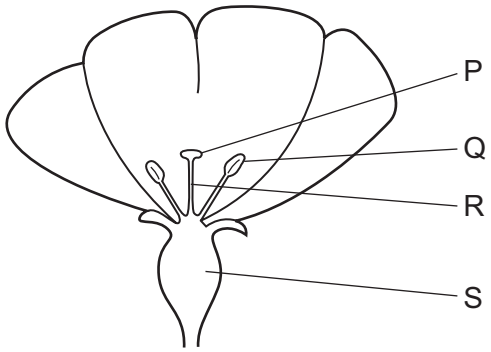

After pollination, where would pollen grains be found?

A P and Q **B** P and S **C** Q and R **D** R and S

View solution

25 The diagram shows the human female reproductive system.

Where does fertilisation normally take place?

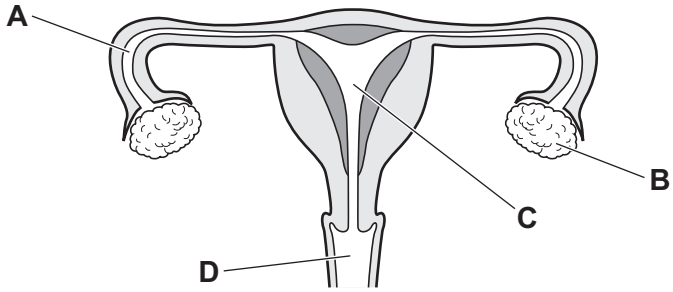

26 The diagram shows a developing fetus.

View solution

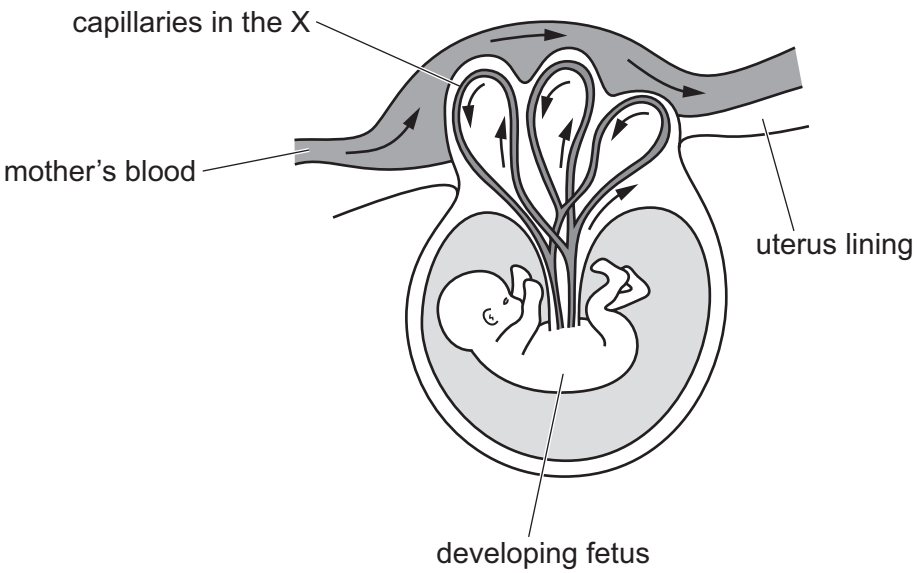

Which structure is represented by X?

A amniotic sac

B cervix

C placenta

D umbilical cord

27 Which statements describe methods of transmission of HIV?

View solution

1 eating contaminated food

2 exchange of blood between individuals

3 from a mother to a fetus in pregnancy

4 insect bites

5 unprotected sex

A 1, 2 and 5 **B** 1, 3 and 4 **C** 2, 3 and 5 **D** 5 only

28 What does a gene code for?

View solution

A a carbohydrate

B a fat

C a protein

D DNA

© UCLES 2025

29 In a species of mammal, the allele for short hair, H, is dominant and the allele for long hair, h, is recessive.

View solution

A heterozygous individual breeds with a long-haired individual.

What is the expected ratio of the phenotypes in the offspring?

A 100% short-haired, 0% long-haired

B 75% short-haired, 25% long-haired

C 50% short-haired, 50% long-haired

D 25% short-haired, 75% long-haired

View solution

30 Which statement about variation and example is correct?

A Continuous variation is caused by the environment and genes. An example is ABO blood groups.

B Continuous variation is usually caused by genes only. An example is body mass.

C Discontinuous variation is caused by both the environment and genes. An example is body mass.

D Discontinuous variation is usually caused by genes only. An example is ABO blood groups.

31 The diagram shows the energy within the producers in an ecosystem and how much is transferred to primary consumers and eventually lost to the environment.

View solution

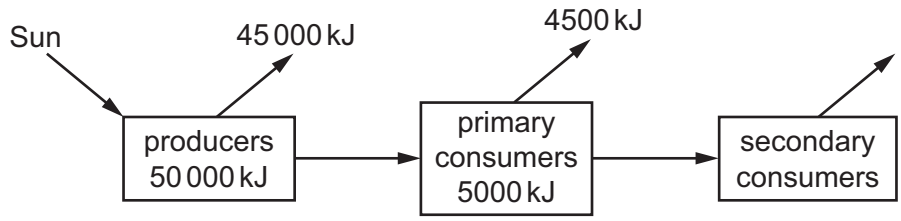

How much energy is transferred from primary consumers to secondary consumers?

A 5 kJ **B** 50 kJ **C** 500 kJ **D** 5000 kJ

© UCLES 2025

32 The diagram represents part of an aquatic food web.

View solution

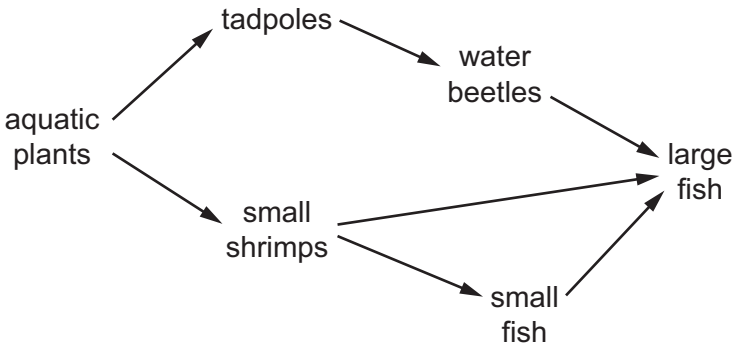

Which organisms are primary consumers in this food web?

A small shrimps and tadpoles

B tadpoles and small fish

C water beetles and large fish

D water beetles and small fish

33 In a greenhouse there were many aphids feeding on 10 tomato plants.

View solution

A population of 20 ladybirds, which are a predator of aphids, was introduced into the greenhouse.

Which pyramid of numbers correctly represents this food chain?

A

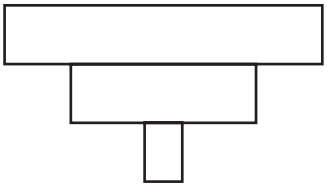

B

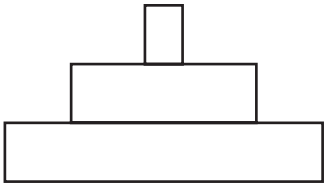

C

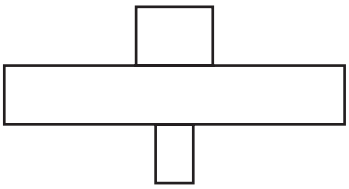

D

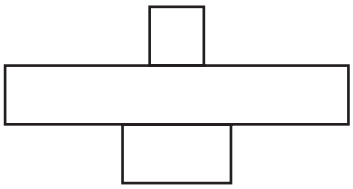

© UCLES 2025

34 Which arrow represents respiration in plants?

View solution

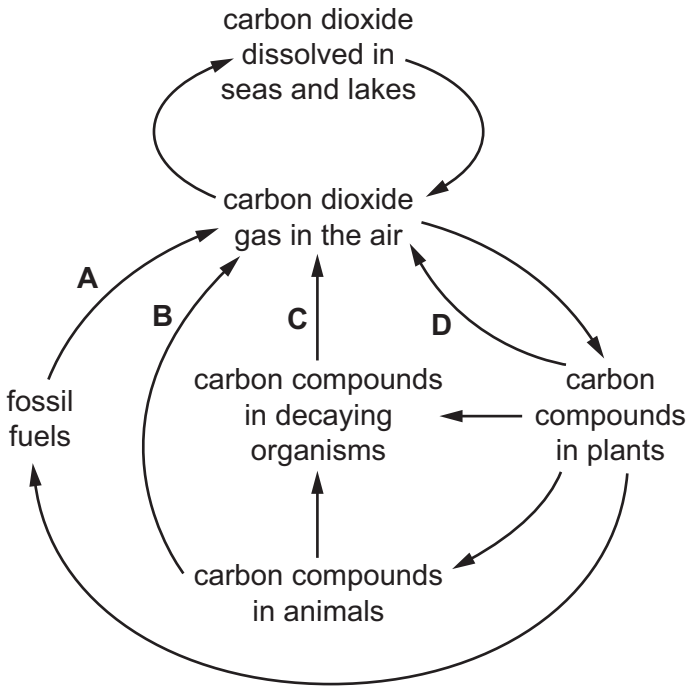

35 What is the correct sequence for the stages in a sigmoid population growth curve?

View solution

A lag → log → stationary

B log → lag → stationary

C stationary → lag → log

D stationary → log → lag

36 The graphs show the number of carnivores in a habitat over a period of time. At time X, the herbivores in the food chain are removed from the habitat.

View solution

Which graph shows the likely effect of this on the number of carnivores?

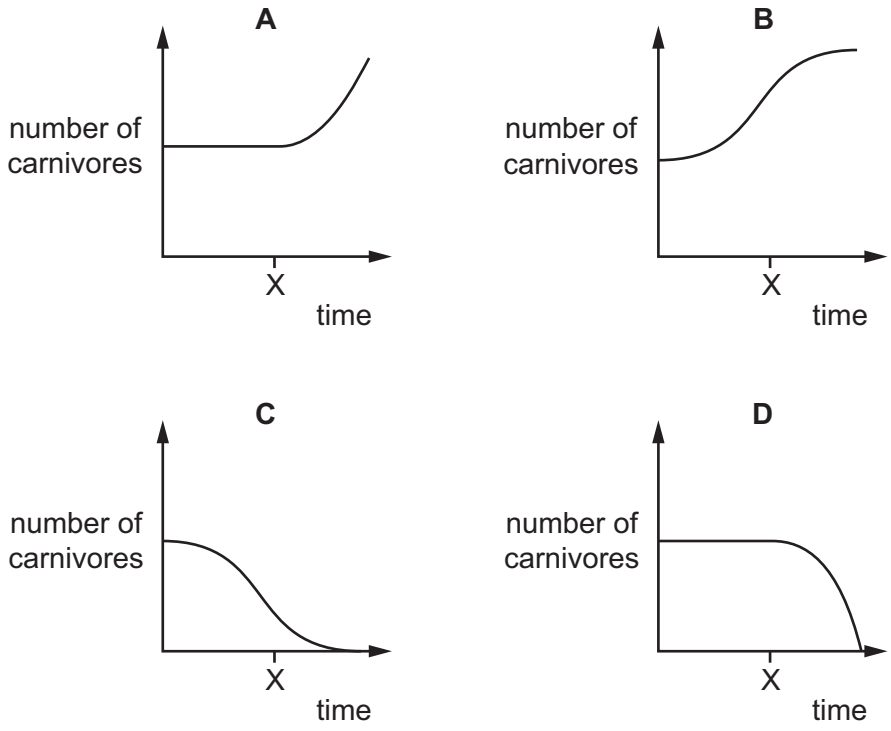

View solution

37 What is used to reduce competition from weeds when growing crops?

A deforestation

B fertiliser

C herbicide

D insecticide

View solution

38 Which statements describe the effects of deforestation?

1 Biodiversity increases.

2 The level of carbon dioxide in the atmosphere increases.

3 Soil is lost from the area.

4 There is a decrease in flooding.

A 1 and 2 **B** 1 and 4 **C** 2 and 3 **D** 3 and 4

© UCLES 2025

39 Which substance is a greenhouse gas?

View solution

A herbicide

B insecticide

C methane

D oxygen

40 Biological washing powders contain enzymes.

View solution

Which enzyme removes an oil stain from clothes?

A amylase

B lipase

C pectinase

D protease

BLANK PAGE

BLANK PAGE

Permission to reproduce items where third-party owned material protected by copyright is included has been sought and cleared where possible. Every reasonable effort has been made by the publisher (UCLES) to trace copyright holders, but if any items requiring clearance have unwittingly been included, the publisher will be pleased to make amends at the earliest possible opportunity.

To avoid the issue of disclosure of answer-related information to candidates, all copyright acknowledgements are reproduced online in the Cambridge Assessment International Education Copyright Acknowledgements Booklet. This is produced for each series of examinations and is freely available to download at www.cambridgeinternational.org after the live examination series.

Cambridge Assessment International Education is part of Cambridge Assessment. Cambridge Assessment is the brand name of the University of Cambridge Local Examinations Syndicate (UCLES), which is a department of the University of Cambridge.

© UCLES 2025