Cambridge Assessment International Education

Cambridge IGCSE™

CANDIDATE NAME									
CENTRE NUMBER						CANDIDATE NUMBER				

BIOLOGY **0610/32**

Paper 3 Theory (Core) **October/November 2025**

1 hour 15 minutes

You must answer on the question paper.

No additional materials are needed.

INSTRUCTIONS

- Answer **all** questions.
- Use a black or dark blue pen. You may use an HB pencil for any diagrams or graphs.
- Write your name, centre number and candidate number in the boxes at the top of the page.
- Write your answer to each question in the space provided.
- Do **not** use an erasable pen or correction fluid.
- Do **not** write on any bar codes.
- You may use a calculator.
- You should show all your working and use appropriate units.

INFORMATION

- The total mark for this paper is 80.
- The number of marks for each question or part question is shown in brackets [ ].

This document has **20** pages. Any blank pages are indicated.

© UCLES 2025

1 **(a)** Fig. 1.1 shows the skeletons of five organisms.

View solution

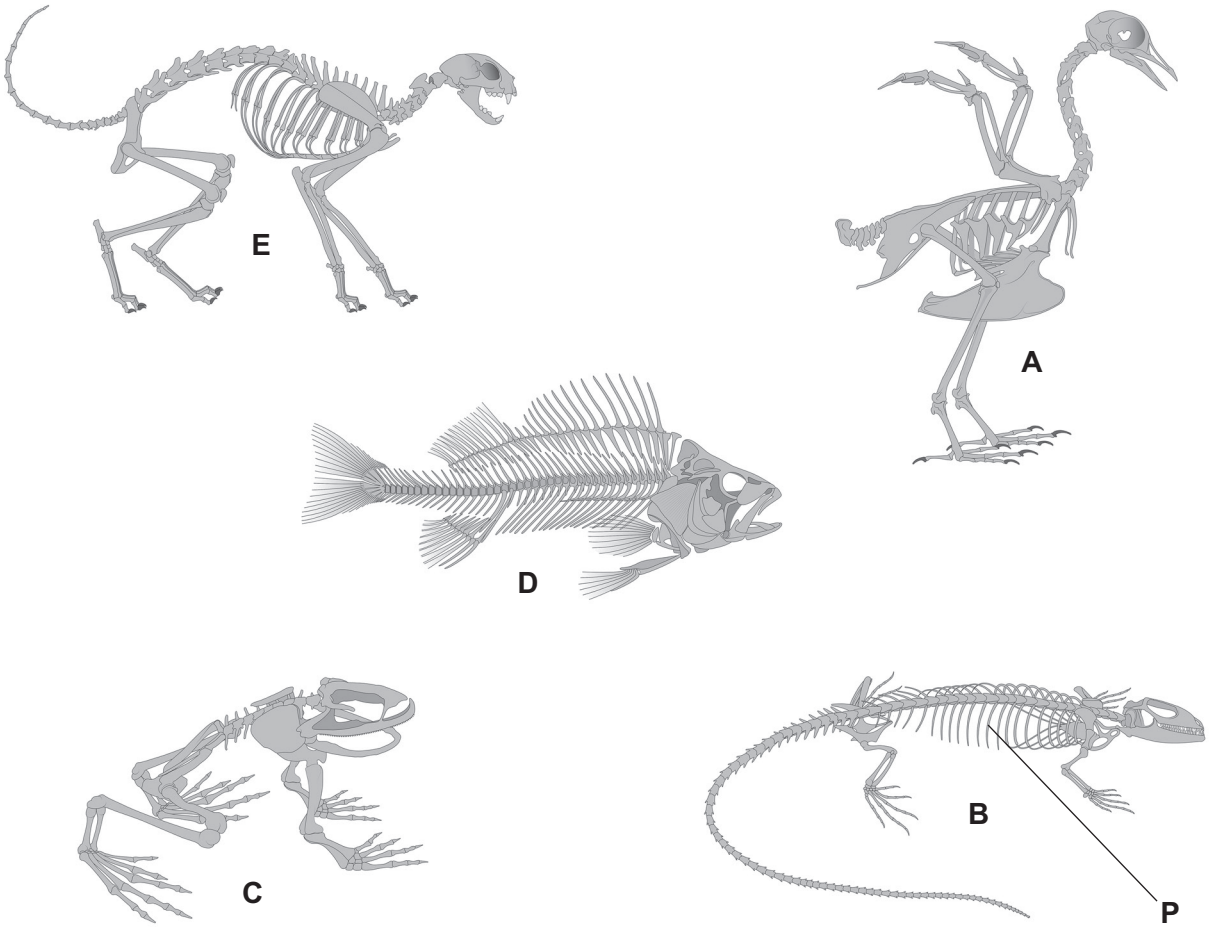

not to scale

Fig. 1.1

(i) State the name of the kingdom to which the organisms in Fig. 1.1 belong.

..... [1]

(ii) The organisms in Fig. 1.1 can be classified into a group because they have a common feature which is visible in the diagram.

State the name of this group.

View solution

..... [1]

(iii) State **one** feature, visible in Fig. 1.1, that identifies organism **D** as a fish.

..... [1]

View solution

(iv) Organism **E** is a mammal.

State **two** features that are found in most mammals.

View solution

1 .....

2 .....

[2]

(v) State the name of the structure labelled **P** in Fig. 1.1.

View solution

..... [1]

(b) The scientific name for organism **A** in Fig. 1.1 is *Phasianus colchicus*.

View solution

(i) State the species name for organism **A**.

..... [1]

(ii) Describe what is meant by the term species.

View solution

.....

.....

..... [2]

[Total: 9]

2 Fig. 2.1 shows red blood cells in three different concentrations of salt solution.



Fig. 2.1

(a) **(i)** Using the information in Fig. 2.1, state the letter of the salt solution that has a concentration similar to blood plasma.

View solution

Explain your choice.

salt solution .....

explanation .....

.....

.....

[2]

(ii) Using the information in Fig. 2.1, list the salt solutions, **A**, **B** and **C**, in order of **increasing** salt concentration.

View solution

lowest ⟶ highest

..... [1]

(b) State the names of **two** substances, other than blood cells, that are transported in blood plasma.

1 .....

2 .....

[2]

View solution

(c) Plant tissues can be used to investigate osmosis.

View solution

Describe the appearance of a plant cell after being placed in distilled water for one hour.

.....

.....

.....

.....

..... [2]

(d) Table 2.1 contains statements about the movement of substances.

Place ticks (✓) in the rows to indicate if the statement is true for diffusion or osmosis or both.

View solution

Table 2.1

statement	diffusion	osmosis
happens in all living cells		
particles move randomly		
always involves a partially permeable membrane		
ions move down a concentration gradient		

[4]

(e) State the name of the type of movement of particles that uses energy from respiration.

..... [1]

[Total: 12]

View solution

3 **(a)** Fig. 3.1 shows part of a tree that is infected with a pathogen.

View solution



Fig. 3.1

(i) Suggest **two** processes that cannot occur in the infected leaf that can occur in the uninfected leaf in Fig. 3.1.

1 .....

.....

2 .....

.....

[2]

(ii) State the names of **two** types of pathogen.

1 .....

2 .....

[2]

© UCLES 2025

(iii) Suggest **two** ways that pathogens are transmitted between trees.

1 .....

.....

2 .....

.....

[2]

(b) Pathogens are one cause of deforestation.

View solution

Describe other causes of deforestation.

.....

.....

.....

.....

.....

.....

..... [3]

(c) Fig. 3.2 shows the area of rainforest that was removed between 2004 and 2022 in one country.

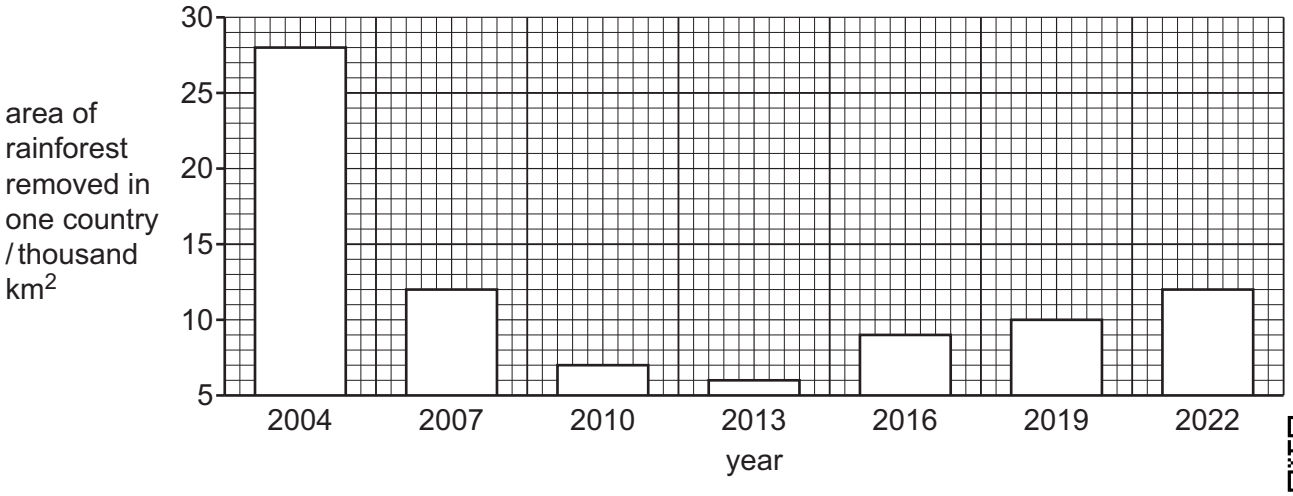

View solution

Fig. 3.2

Describe the data shown in Fig. 3.2.

.....

.....

.....

.....

.....

.....

..... [3]

(d) One undesirable effect of deforestation is a reduction in biodiversity.

View solution

(i) Describe what is meant by the term biodiversity.

.....

.....

..... [2]

(ii) Describe undesirable effects of deforestation, **other than** reducing biodiversity.

.....

.....

.....

.....

.....

.....

..... [3]

[Total: 17]

View solution

4 **(a)** Fig. 4.1 is a diagram of the female reproductive system.

View solution

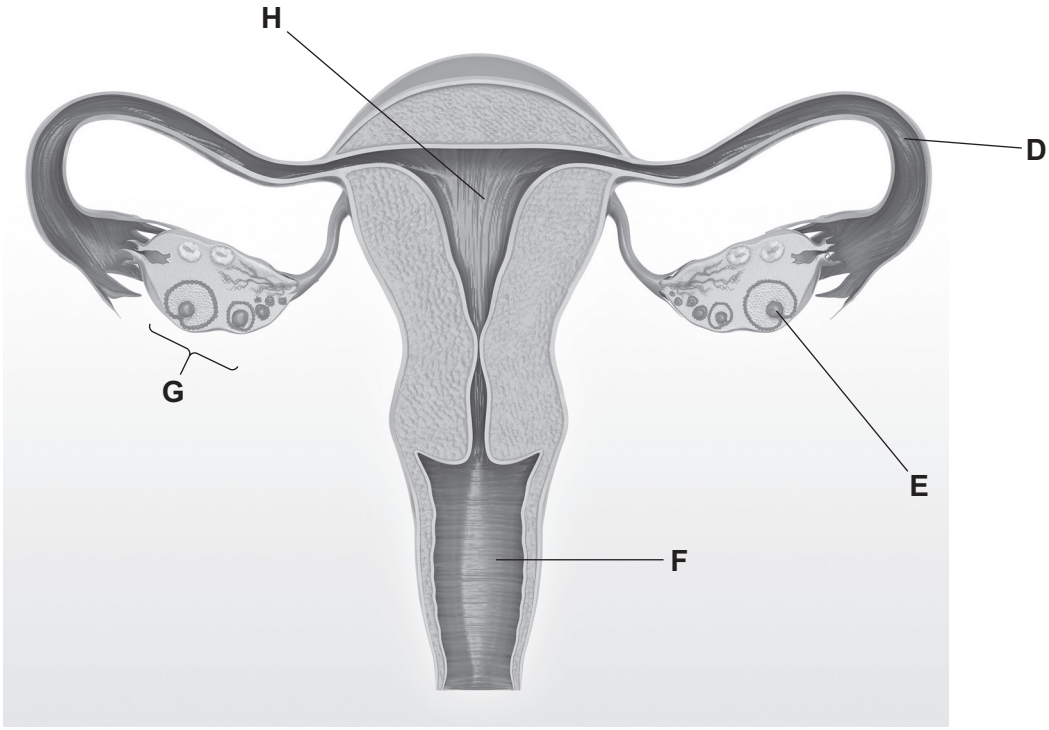

Fig. 4.1

(i) State the letter in Fig. 4.1 that identifies:

the vagina .....

an oviduct .....

an egg cell. .....

[3]

(ii) Draw a label line and the letter **X** on Fig. 4.1 to show where fertilisation normally occurs.
[1]

(iii) State the name of the organ shown in Fig. 4.1 that produces a female reproductive hormone and state **one** function of the hormone.

organ .....

function .....

.....

.....

[2]

© UCLES 2025

(b) Complete the sentences about the endocrine system using words from the list.

View solution

Each word may be used once, more than once or not at all.

digestion external glands glucose

homeostasis insulin internal

muscles neurones phagocytosis testosterone tissues

The endocrine system contains organs called ..... . These organs produce hormones.

Some hormones help to maintain a constant ..... environment. This is called ..... .

The pancreas produces a hormone called ..... that helps to control blood ..... concentration.

[5]

[Total: 11]

5 Pea plants produce seeds in pods.

The colour of pea pods is controlled by a single gene.

Some pea pods are green and some are yellow.

The allele for green is dominant and is represented by the letter **G**.

The allele for yellow is recessive and is represented by the letter **g**.

View solution

(a) Describe what is meant by the term allele.

.....

..... [2]

View solution

(b) Fig. 5.1 is a pedigree diagram for the inheritance of pod colour in some pea plants.

Key

green pod

yellow pod

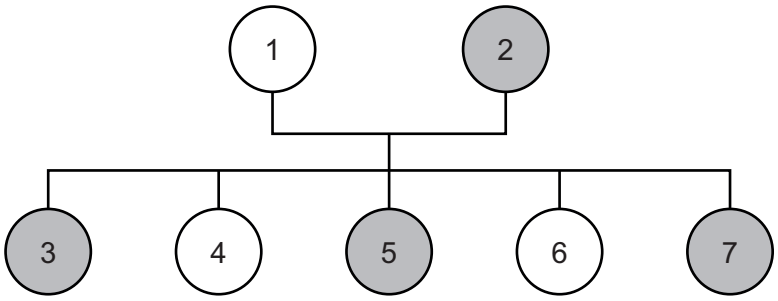

Fig. 5.1

© UCLES 2025

The possible genotypes for pea pod colour are **GG**, **Gg** and **gg**.

Determine the genotypes of individual 1 and individual 2 in Fig. 5.1.

Explain how you determined your answer for each individual.

individual 1 genotype .....

explanation .....

.....

.....

individual 2 genotype .....

explanation .....

.....

.....

[4]

(c) Two pea plants with the genotype **Gg** for pod colour are bred together.

Complete the Punnett square to determine the possible genotypes of the offspring and calculate the expected phenotypic ratio.

View solution

	.....	.....
.....	.....	.....
.....	.....	.....

The expected phenotypic ratio of the offspring is ..... green pods : ..... yellow pods.

[3]

[Total: 9]

6 **(a)** Fig. 6.1 is a diagram of a spongy mesophyll cell.

View solution

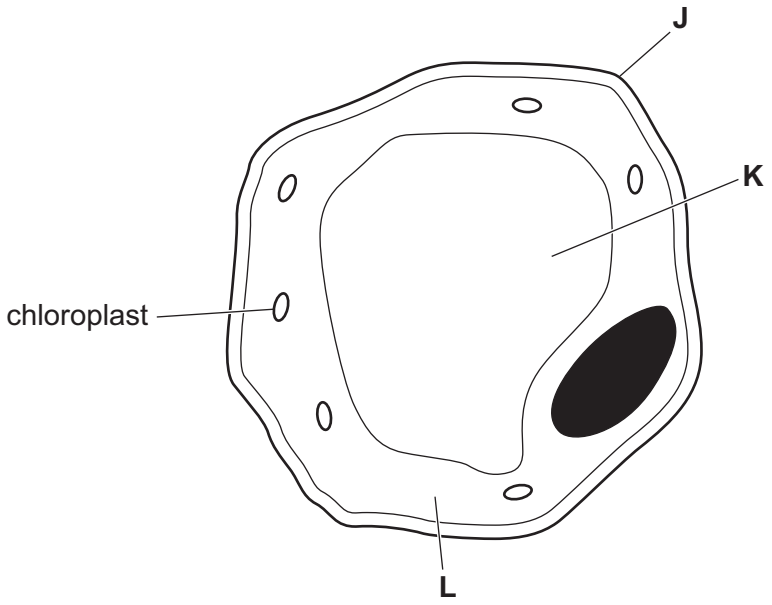

Fig. 6.1

(i) State the name of the organ that contains spongy mesophyll cells.

..... [1]

(ii) State the names of structures **J**, **K** and **L** in Fig. 6.1.

J .....

K .....

L .....

[3]

(iii) Describe **one** function of the nucleus.

.....

.....

..... [1]

(iv) Draw an **M** on Fig. 6.1 to show where mitochondria are found. [1]

(v) State the function of mitochondria.

.....

..... [1]

(b) Explain how the spongy mesophyll **tissue** is adapted for photosynthesis.

.....

.....

.....

.....

.....

.....

..... [3]

[Total: 10]

View solution

7 **(a)** The boxes on the left show the types of digestion.

The boxes on the right contain sentence endings.

Draw lines to make **four** correct sentences.

View solution

type of digestion	sentence ending
Chemical digestion	breaks down food into smaller pieces.
	breaks down food molecules.
Physical digestion	involves chemical changes.
	involves enzymes.

[4]

(b) Ingestion occurs in the mouth.

View solution

State the name of the part of the alimentary canal where egestion occurs.

..... [1]

© UCLES 2025

(c) Fig. 7.1 shows a section through a human tooth.

View solution

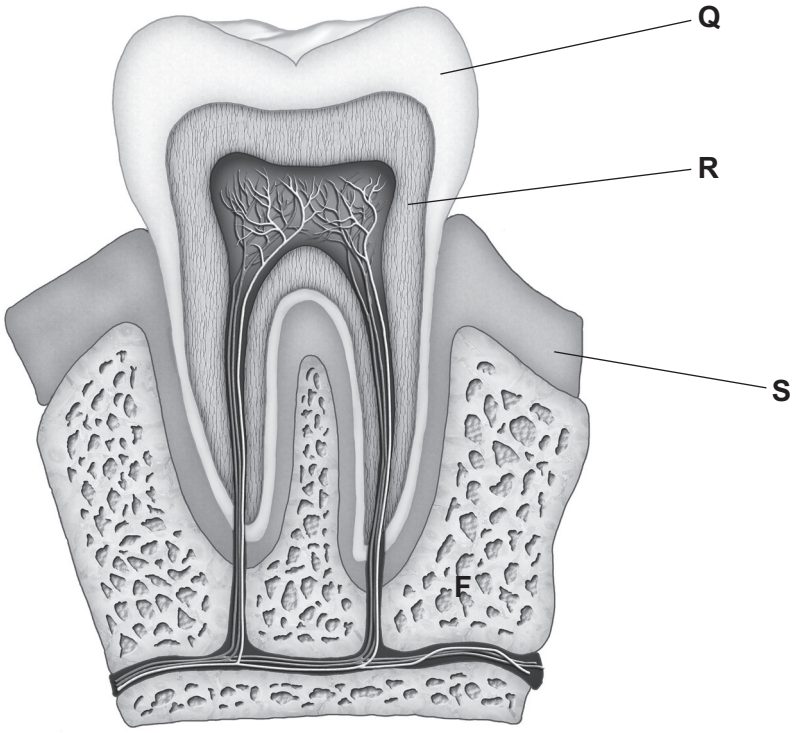

Fig. 7.1

(i) State the names of structures **Q**, **R** and **S** in Fig. 7.1.

Q .....

R .....

S .....

[3]

(ii) State the names of **two** structures found inside the pulp.

View solution

1 .....

2 .....

[2]

(iii) Identify the type of tooth shown in Fig. 7.1.

View solution

Explain how you made your choice.

type .....

explanation .....

.....

.....

[2]

[Total: 12]

© UCLES 2025

BLANK PAGE

© UCLES 2025

BLANK PAGE

BLANK PAGE

Permission to reproduce items where third-party owned material protected by copyright is included has been sought and cleared where possible. Every reasonable effort has been made by the publisher (UCLES) to trace copyright holders, but if any items requiring clearance have unwittingly been included, the publisher will be pleased to make amends at the earliest possible opportunity.

To avoid the issue of disclosure of answer-related information to candidates, all copyright acknowledgements are reproduced online in the Cambridge Assessment International Education Copyright Acknowledgements Booklet. This is produced for each series of examinations and is freely available to download at www.cambridgeinternational.org after the live examination series.

Cambridge Assessment International Education is part of Cambridge Assessment. Cambridge Assessment is the brand name of the University of Cambridge Local Examinations Syndicate (UCLES), which is a department of the University of Cambridge.

© UCLES 2025